Création d'expressions pour le volume Nom:

Créez une expression pour déterminer le volume de chaque boîte.

1)

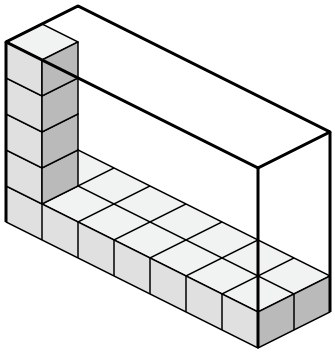

2)

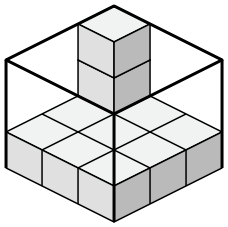

3)

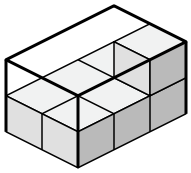

4)

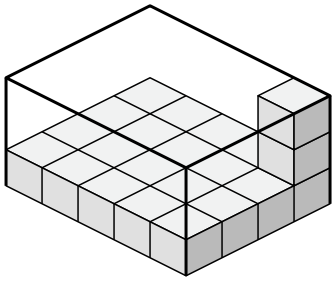

5)

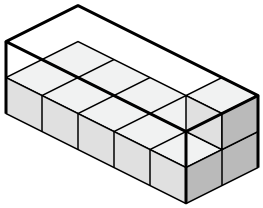

6)

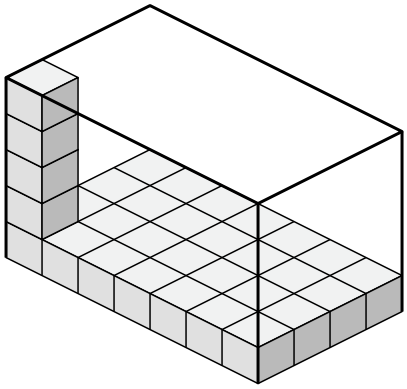

7)

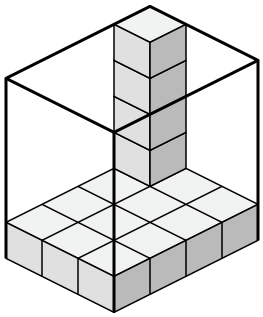

8)

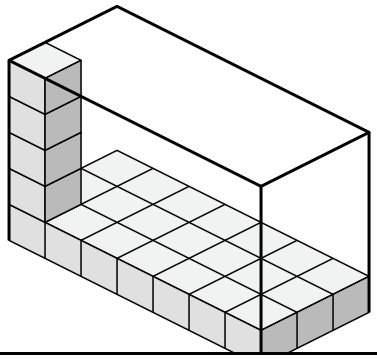

Réponses

1. _____
2. _____
3. _____
4. _____
5. _____
6. _____
7. _____
8. _____

1-8	88	75	63	50	38	25	13	0

Création d'expressions pour le volume Nom: **Clé**

Créez une expression pour déterminer le volume de chaque boîte.

1)

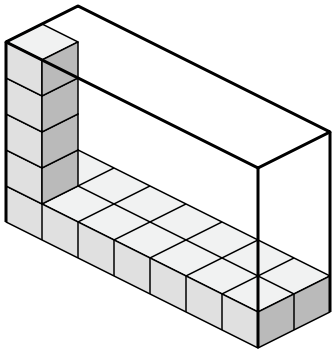

2)

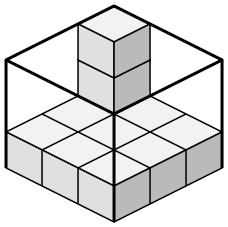

3)

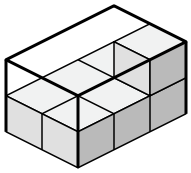

4)

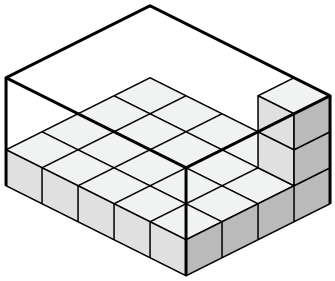

5)

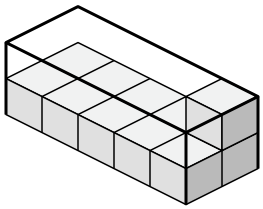

6)

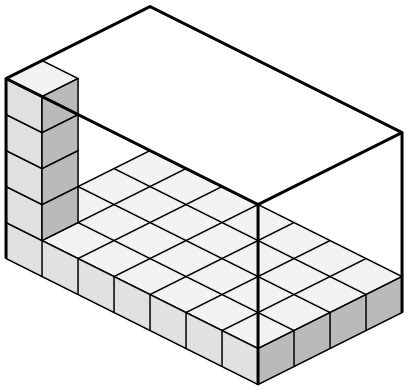

7)

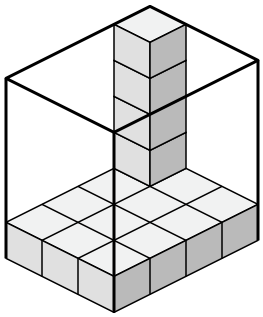

8)

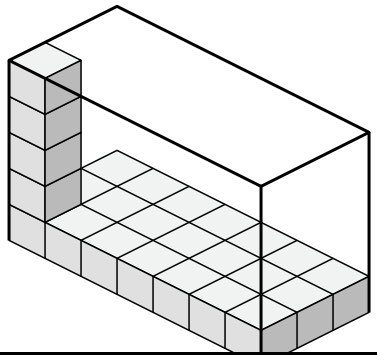

Réponses

1. 7×2×5
2. 3×3×3
3. 2×3×2
4. 5×4×3
5. 5×2×2
6. 7×4×5
7. 3×4×5
8. 7×3×5

1-8	88	75	63	50	38	25	13	0