Trouvez la valeur de X pour chaque chiffre. Chaque chiffre est en centimètres (cm). Pas à l'échelle.

1) area = 73,6725 cm^2

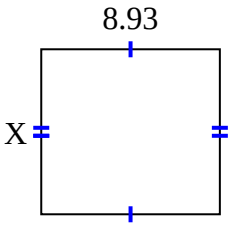

2) area = 34,615 cm^2

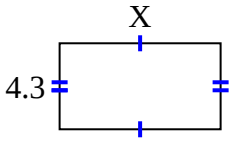

3) area = 39,864 cm^2

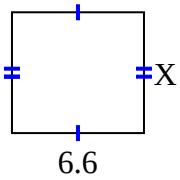

4) area = 57,42 cm^2

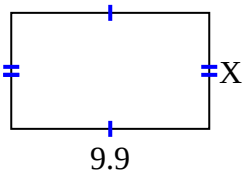

5) area = 23,598 cm^2

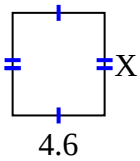

6) area = 14,3 cm^2

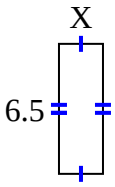

7) area = 36,3795 cm^2

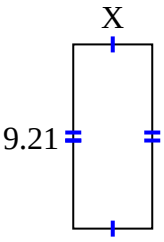

8) area = 64,251 cm^2

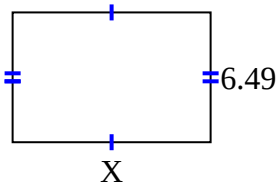

9) area = 9,361 cm^2

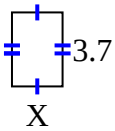

10) area = 25,235 cm^2

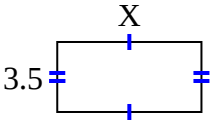

11) area = 46,8366 cm^2

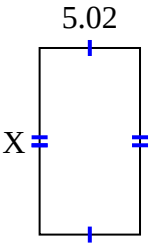

12) area = 8,925 cm^2

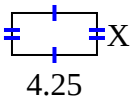

13) area = 14,6804 cm^2

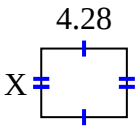

14) area = 79,98 cm^2

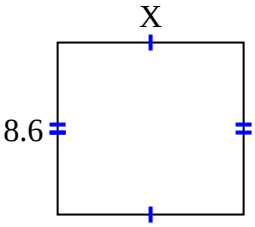

15) area = 25,996 cm^2

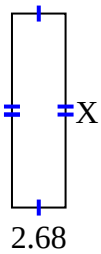

Réponses

1. _____
2. _____
3. _____
4. _____
5. _____
6. _____
7. _____
8. _____
9. _____
10. _____
11. _____
12. _____
13. _____
14. _____
15. _____

1-10	93	87	80	73	67	60	53	47	40	33
11-15	27	20	13	7	0					

Trouvez la valeur de X pour chaque chiffre. Chaque chiffre est en centimètres (cm). Pas à l'échelle.

1) area = 73,6725 cm^2

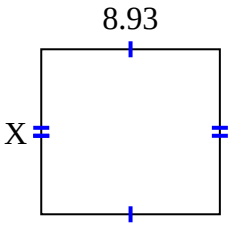

2) area = 34,615 cm^2

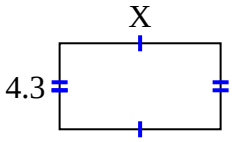

3) area = 39,864 cm^2

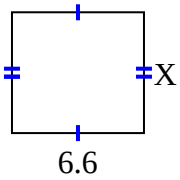

4) area = 57,42 cm^2

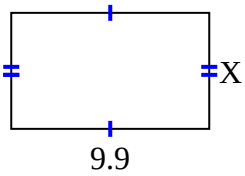

5) area = 23,598 cm^2

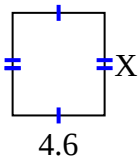

6) area = 14,3 cm^2

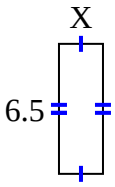

7) area = 36,3795 cm^2

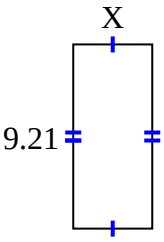

8) area = 64,251 cm^2

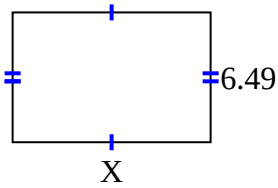

9) area = 9,361 cm^2

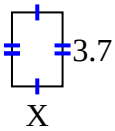

10) area = 25,235 cm^2

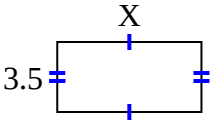

11) area = 46,8366 cm^2

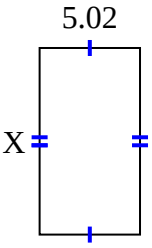

12) area = 8,925 cm^2

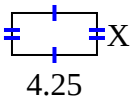

13) area = 14,6804 cm^2

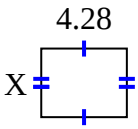

14) area = 79,98 cm^2

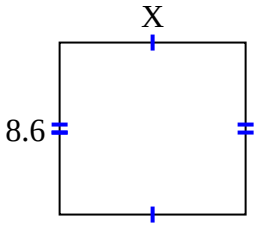

15) area = 25,996 cm^2

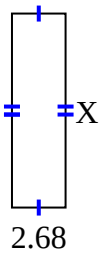

Réponses

1. **8.25**
2. **8.05**
3. **6.04**
4. **5.8**
5. **5.13**
6. **2.2**
7. **3.95**
8. **9.9**
9. **2.53**
10. **7.21**
11. **9.33**
12. **2.1**
13. **3.43**
14. **9.3**
15. **9.7**

1-10	93	87	80	73	67	60	53	47	40	33
11-15	27	20	13	7	0					