Déterminez la largeur, la hauteur et l'aire réelles de chaque rectangle d'échelle. Arrondissez la zone au nombre entier le plus proche.

1)

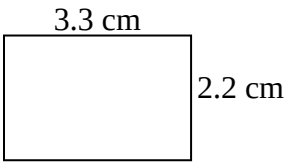

1 cm = 9 ft

2)

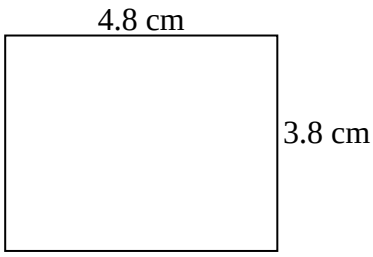

1 cm = 7 ft

3)

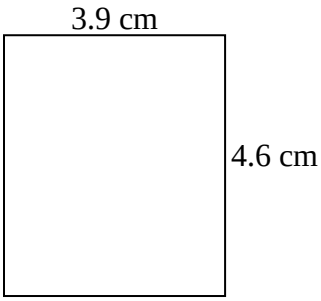

1 cm = 2 ft

4)

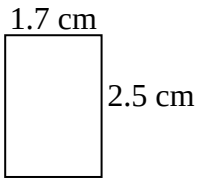

1 cm = 9 ft

5)

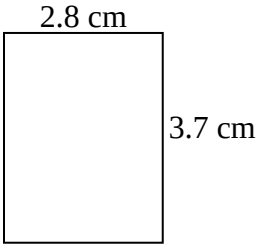

1 cm = 6 ft

6)

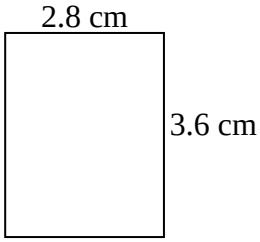

1 cm = 10 ft

7)

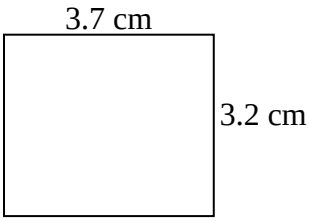

1 cm = 10 ft

8)

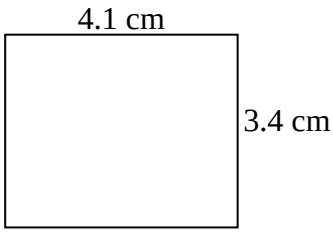

1 cm = 6 ft

Réponses

1. _____ _____ _____
2. _____ _____ _____
3. _____ _____ _____
4. _____ _____ _____
5. _____ _____ _____
6. _____ _____ _____
7. _____ _____ _____
8. _____ _____ _____

1-8	88	75	63	50	38	25	13	0

Recherche de rectangles de largeur, de hauteur et d'aire d'échelle Nom: **Clé**

Déterminez la largeur, la hauteur et l'aire réelles de chaque rectangle d'échelle. Arrondissez la zone au nombre entier le plus proche.

1)

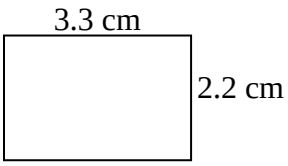

1 cm = 9 ft

2)

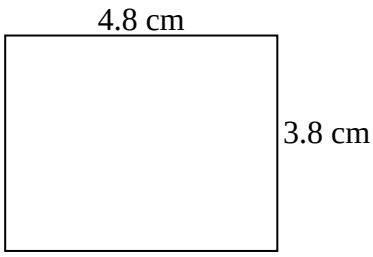

1 cm = 7 ft

3)

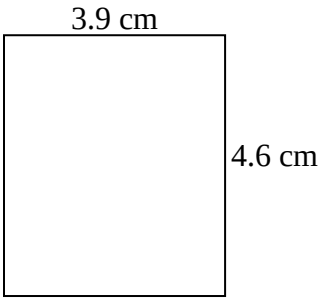

1 cm = 2 ft

4)

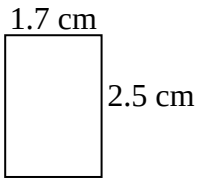

1 cm = 9 ft

5)

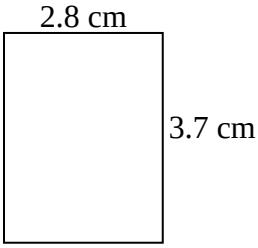

1 cm = 6 ft

6)

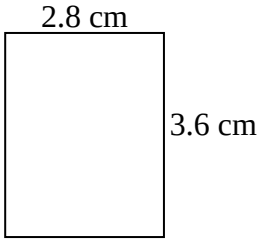

1 cm = 10 ft

7)

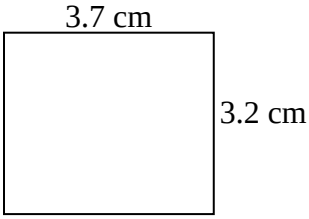

1 cm = 10 ft

8)

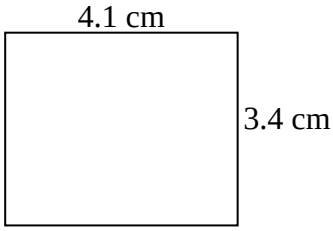

1 cm = 6 ft

Réponses

1.	29.7	19.8	588
2.	33.6	26.6	894
3.	7.8	9.2	72
4.	15.3	22.5	344
5.	16.8	22.2	373
6.	28	36	1 008
7.	37	32	1 184
8.	24.6	20.4	502

1-8	88	75	63	50	38	25	13	0