Compter les formes

Nom:

Comptez le nombre de formes affichées.

1)

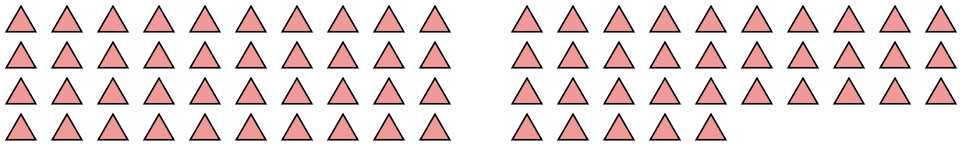

2)

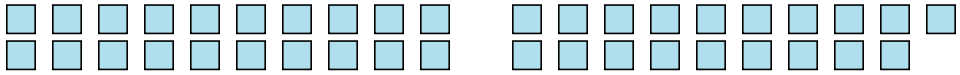

3)

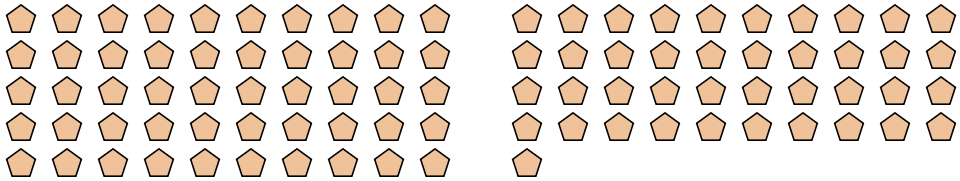

4)

5)

Réponses

1. _____
2. _____
3. _____
4. _____
5. _____

1-5	80	60	40	20	0

Compter les formes

Nom: **Clé**

Comptez le nombre de formes affichées.

1) 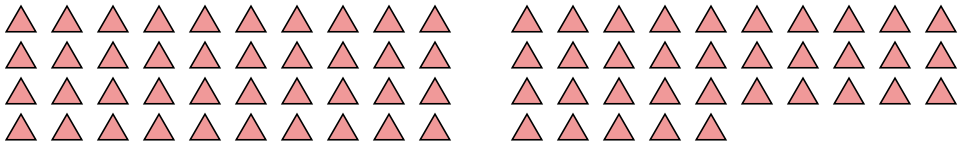

2) 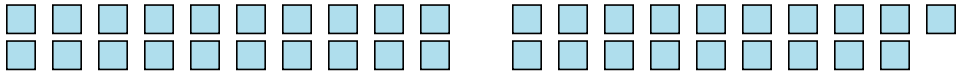

3) 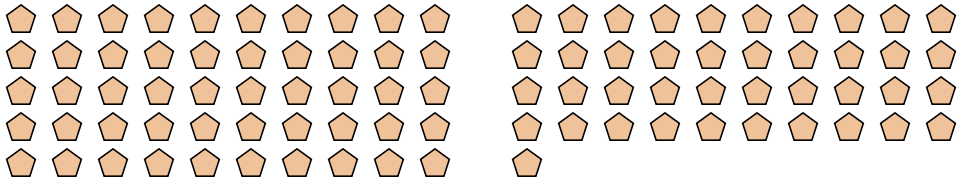

4)

5)

Réponses

1. **75**
2. **39**
3. **91**
4. **15**
5. **106**

1-5	80	60	40	20	0