Classement Visuel de Nombres Décimaux

Nom:

Classer les grilles, en fonction des zones colorées, de la plus petite à la plus grande.

Ex) A B C D

petite 0.2 - B
0.6 - D
0.86 - C
grande 0.91 - A

1) A B C D

petite _____
_____
_____
grande _____

2) A B C D

petite _____
_____
_____
grande _____

3) A B C D

petite _____
_____
_____
grande _____

4) A B C D

petite _____
_____
_____
grande _____

5) A B C D

petite _____
_____
_____
grande _____

6) A B C D

petite _____
_____
_____
grande _____

7) A B C D

petite _____
_____
_____
grande _____

8) A B C D

petite _____
_____
_____
grande _____

Réponses

Ex. **B,D,C,A**

1. _____
2. _____
3. _____
4. _____
5. _____
6. _____
7. _____
8. _____

1-8	88	75	63	50	38	25	13	0

Classement Visuel de Nombres Décimaux

Nom: **Clé**

Classer les grilles, en fonction des zones colorées, de la plus petite à la plus grande.

Ex)

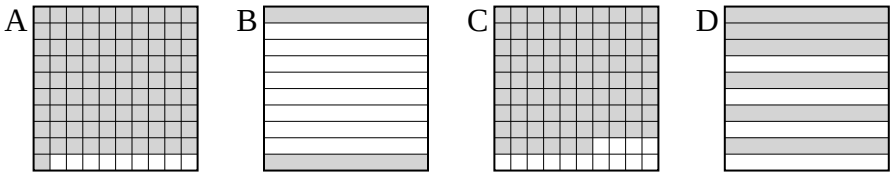

petite 0.2 - B
0.6 - D
0.86 - C
grande 0.91 - A

1)

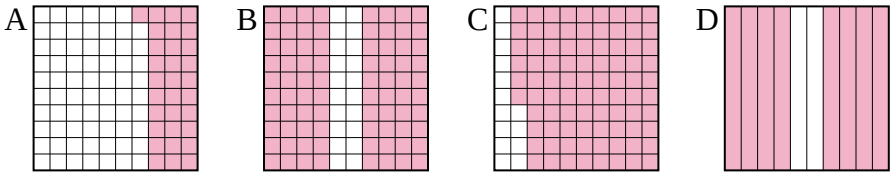

petite 0.31 - A
0.8 - B
0.8 - B
grande 0.86 - C

2)

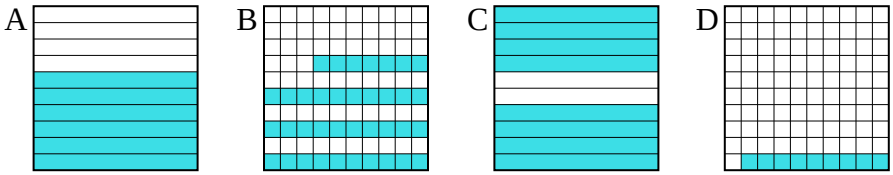

petite 0.09 - D
0.37 - B
0.6 - A
grande 0.8 - C

3)

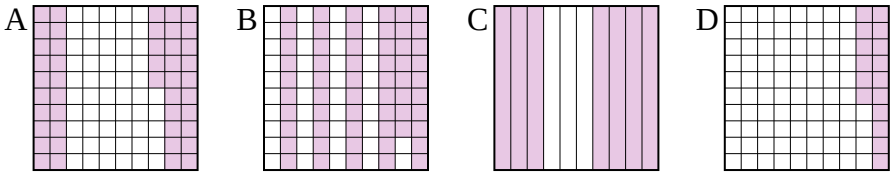

petite 0.16 - D
0.45 - A
0.58 - B
grande 0.7 - C

4)

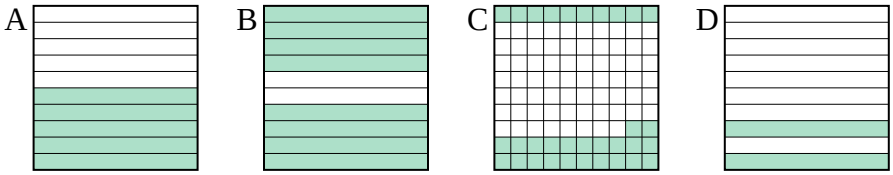

petite 0.2 - D
0.32 - C
0.5 - A
grande 0.8 - B

5)

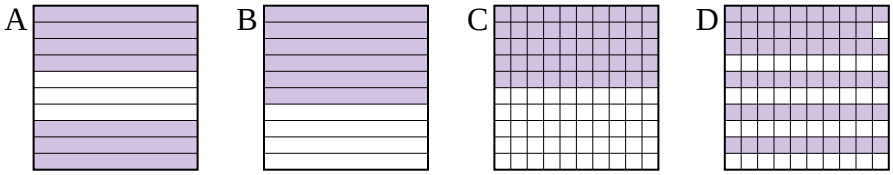

petite 0.5 - C
0.59 - D
0.6 - B
grande 0.7 - A

6)

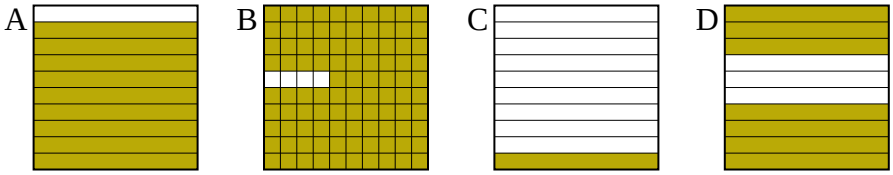

petite 0.1 - C
0.7 - D
0.9 - A
grande 0.96 - B

7)

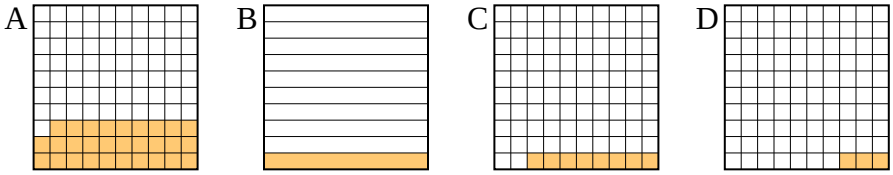

petite 0.03 - D
0.08 - C
0.1 - B
grande 0.29 - A

8)

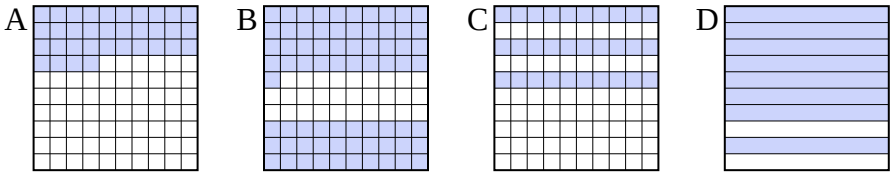

petite 0.3 - C
0.34 - A
0.71 - B
grande 0.8 - D

Réponses

Ex.	B,D,C,A
1.	A,B,B,C
2.	D,B,A,C
3.	D,A,B,C
4.	D,C,A,B
5.	C,D,B,A
6.	C,D,A,B
7.	D,C,B,A
8.	C,A,B,D

1-8	88	75	63	50	38	25	13	0

Classement Visuel de Nombres Décimaux

Nom:

Classer les grilles, en fonction des zones colorées, de la plus petite à la plus grande.

Ex) A B C D

petite 0.05 - B
0.57 - D
0.62 - C
grande 0.9 - A

1) A B C D

petite _____
_____
_____
grande _____

2) A B C D

petite _____
_____
_____
grande _____

3) A B C D

petite _____
_____
_____
grande _____

4) A B C D

petite _____
_____
_____
grande _____

5) A B C D

petite _____
_____
_____
grande _____

6) A B C D

petite _____
_____
_____
grande _____

7) A B C D

petite _____
_____
_____
grande _____

8) A B C D

petite _____
_____
_____
grande _____

Réponses

Ex. **B,D,C,A**

1. _____
2. _____
3. _____
4. _____
5. _____
6. _____
7. _____
8. _____

1-8	88	75	63	50	38	25	13	0

Classement Visuel de Nombres Décimaux

Nom: **Clé**

Classer les grilles, en fonction des zones colorées, de la plus petite à la plus grande.

Ex)

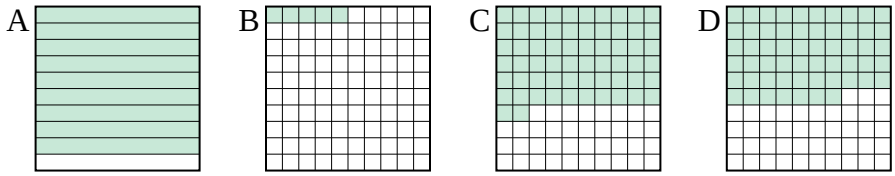

petite 0.05 - B
0.57 - D
0.62 - C
grande 0.9 - A

1)

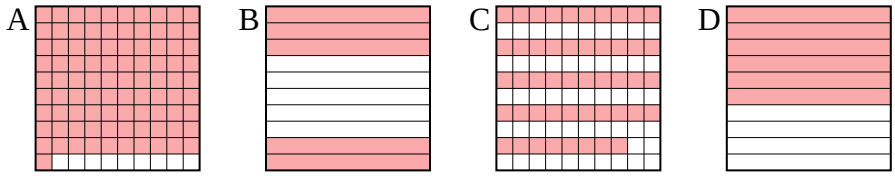

petite 0.48 - C
0.5 - B
0.6 - D
grande 0.91 - A

2)

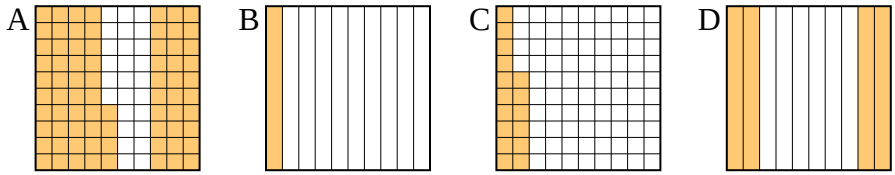

petite 0.1 - B
0.16 - C
0.4 - D
grande 0.74 - A

3)

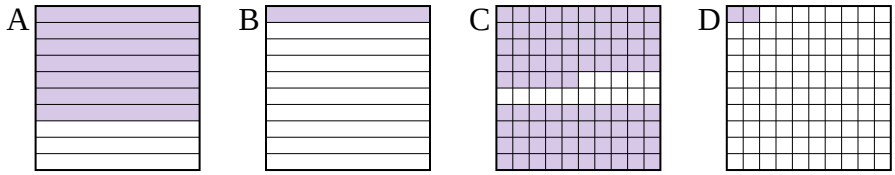

petite 0.02 - D
0.1 - B
0.7 - A
grande 0.85 - C

4)

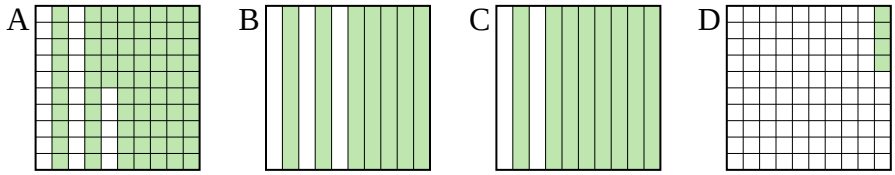

petite 0.04 - D
0.7 - B
0.75 - A
grande 0.8 - C

5)

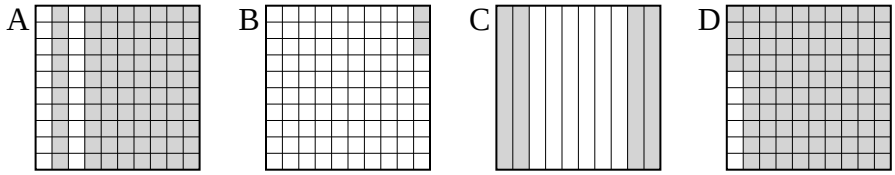

petite 0.03 - B
0.4 - C
0.8 - A
grande 0.94 - D

6)

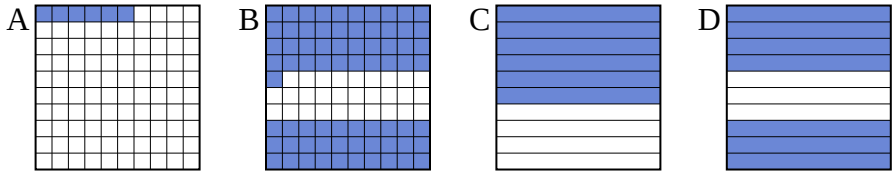

petite 0.06 - A
0.6 - C
0.7 - D
grande 0.71 - B

7)

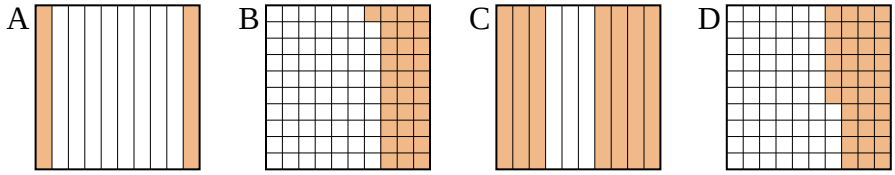

petite 0.2 - A
0.31 - B
0.36 - D
grande 0.7 - C

8)

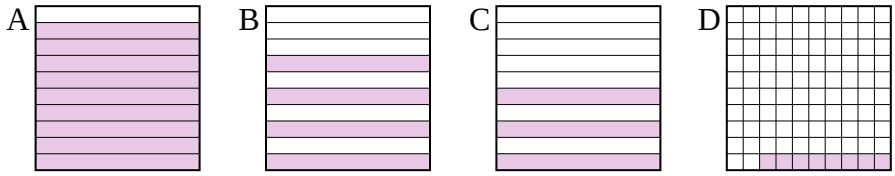

petite 0.08 - D
0.3 - C
0.4 - B
grande 0.9 - A

Réponses

Ex.	B,D,C,A
1.	C,B,D,A
2.	B,C,D,A
3.	D,B,A,C
4.	D,B,A,C
5.	B,C,A,D
6.	A,C,D,B
7.	A,B,D,C
8.	D,C,B,A

1-8	88	75	63	50	38	25	13	0

Classement Visuel de Nombres Décimaux

Nom:

Classer les grilles, en fonction des zones colorées, de la plus petite à la plus grande.

Ex) A B C D

petite 0.05 - B
0.09 - C
0.5 - A
grande 0.6 - D

1) A B C D

petite _____
_____
_____
grande _____

2) A B C D

petite _____
_____
_____
grande _____

3) A B C D

petite _____
_____
_____
grande _____

4) A B C D

petite _____
_____
_____
grande _____

5) A B C D

petite _____
_____
_____
grande _____

6) A B C D

petite _____
_____
_____
grande _____

7) A B C D

petite _____
_____
_____
grande _____

8) A B C D

petite _____
_____
_____
grande _____

Réponses

Ex. **B,C,A,D**

1. _____
2. _____
3. _____
4. _____
5. _____
6. _____
7. _____
8. _____

1-8	88	75	63	50	38	25	13	0

Classement Visuel de Nombres Décimaux

Nom: **Clé**

Classer les grilles, en fonction des zones colorées, de la plus petite à la plus grande.

Ex)

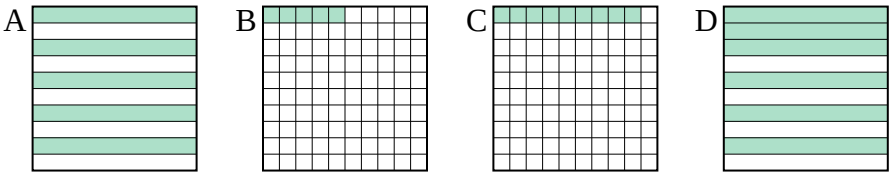

petite 0.05 - B
0.09 - C
0.5 - A
grande 0.6 - D

1)

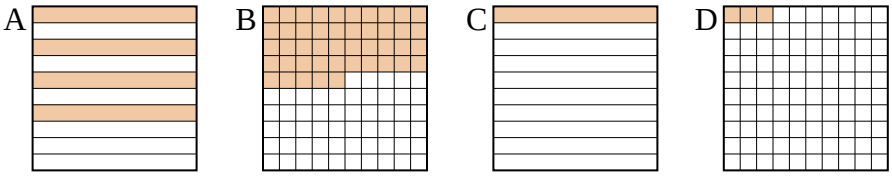

petite 0.03 - D
0.1 - C
0.4 - A
grande 0.45 - B

2)

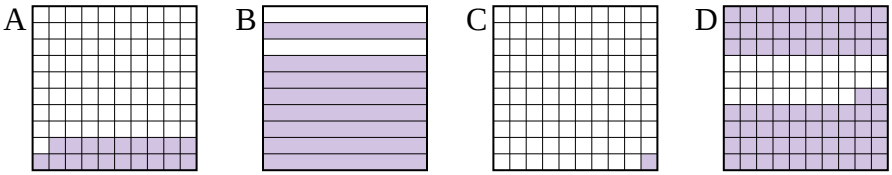

petite 0.01 - C
0.19 - A
0.72 - D
grande 0.8 - B

3)

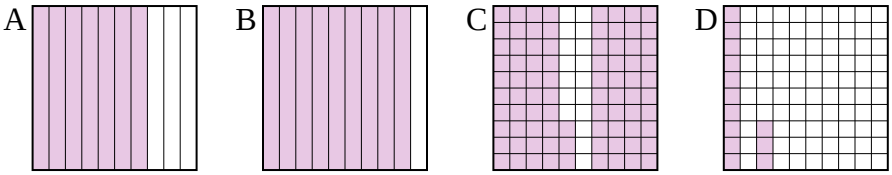

petite 0.13 - D
0.7 - A
0.83 - C
grande 0.9 - B

4)

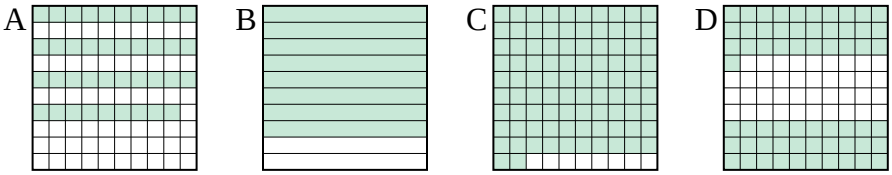

petite 0.39 - A
0.61 - D
0.8 - B
grande 0.92 - C

5)

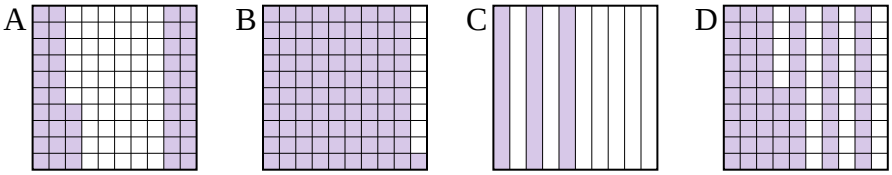

petite 0.3 - C
0.44 - A
0.65 - D
grande 0.91 - B

6)

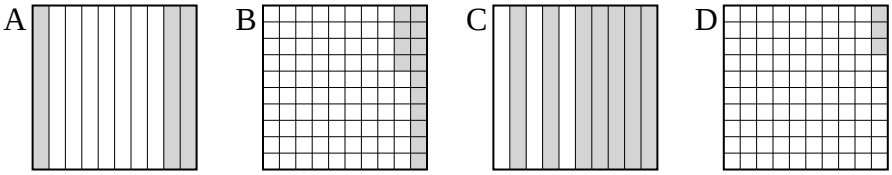

petite 0.03 - D
0.14 - B
0.3 - A
grande 0.7 - C

7)

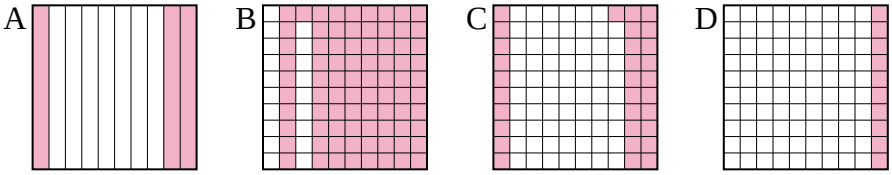

petite 0.1 - D
0.3 - A
0.31 - C
grande 0.81 - B

8)

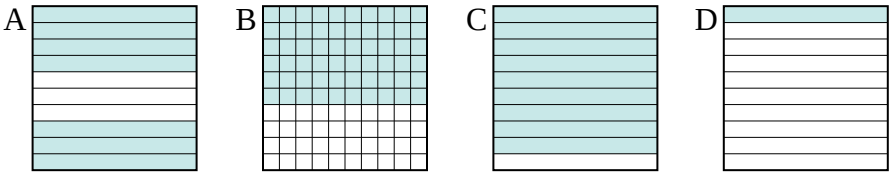

petite 0.1 - D
0.6 - B
0.7 - A
grande 0.9 - C

Réponses

Ex. **B,C,A,D**

1. **D,C,A,B**
2. **C,A,D,B**
3. **D,A,C,B**
4. **A,D,B,C**
5. **C,A,D,B**
6. **D,B,A,C**
7. **D,A,C,B**
8. **D,B,A,C**

1-8	88	75	63	50	38	25	13	0

Classement Visuel de Nombres Décimaux

Nom:

Classer les grilles, en fonction des zones colorées, de la plus petite à la plus grande.

Ex) A B C D

petite 0.2 - A
0.56 - B
0.93 - D
grande 0.99 - C

1) A B C D

petite _____
_____
_____
grande _____

2) A B C D

petite _____
_____
_____
grande _____

3) A B C D

petite _____
_____
_____
grande _____

4) A B C D

petite _____
_____
_____
grande _____

5) A B C D

petite _____
_____
_____
grande _____

6) A B C D

petite _____
_____
_____
grande _____

7) A B C D

petite _____
_____
_____
grande _____

8) A B C D

petite _____
_____
_____
grande _____

Réponses

Ex. **A,B,D,C**

1. _____
2. _____
3. _____
4. _____
5. _____
6. _____
7. _____
8. _____

1-8	88	75	63	50	38	25	13	0

Classement Visuel de Nombres Décimaux Nom: **Clé**

Classer les grilles, en fonction des zones colorées, de la plus petite à la plus grande.

Ex)

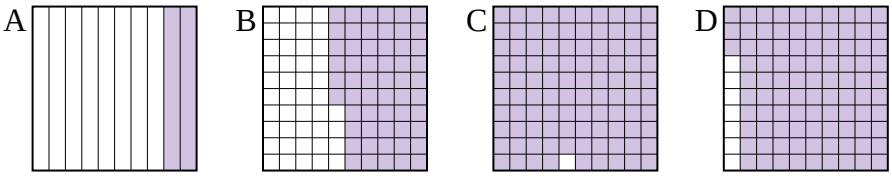

petite 0.2 - A
0.56 - B
0.93 - D
grande 0.99 - C

1)

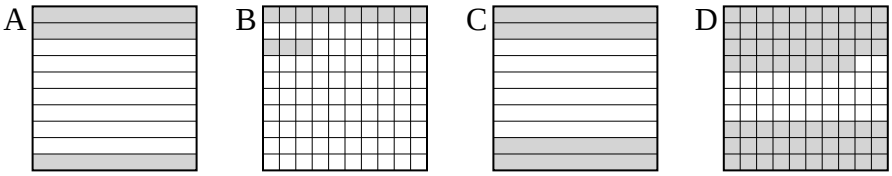

petite 0.13 - B
0.3 - A
0.4 - C
grande 0.68 - D

2)

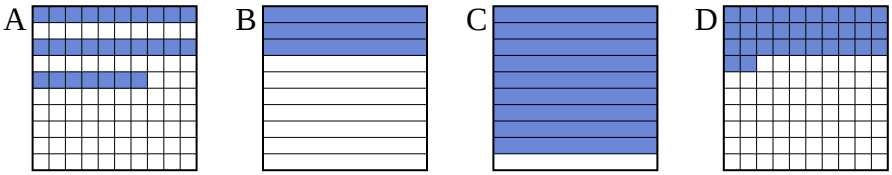

petite 0.27 - A
0.3 - B
0.32 - D
grande 0.9 - C

3)

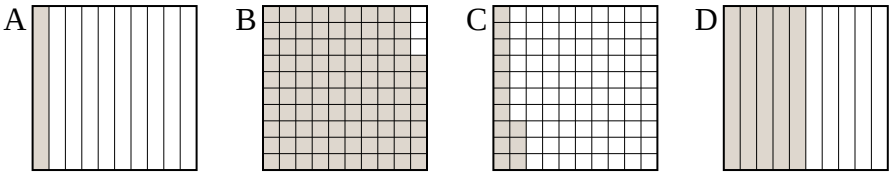

petite 0.1 - A
0.13 - C
0.5 - D
grande 0.97 - B

4)

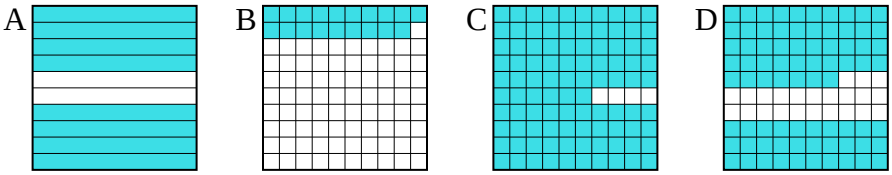

petite 0.19 - B
0.77 - D
0.8 - A
grande 0.96 - C

5)

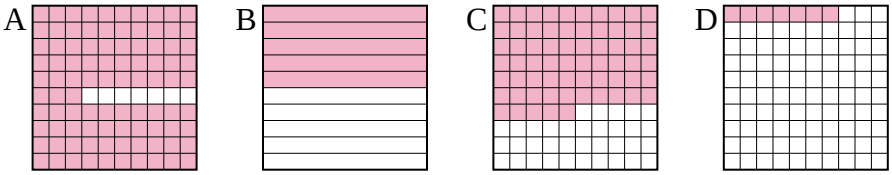

petite 0.07 - D
0.5 - B
0.65 - C
grande 0.93 - A

6)

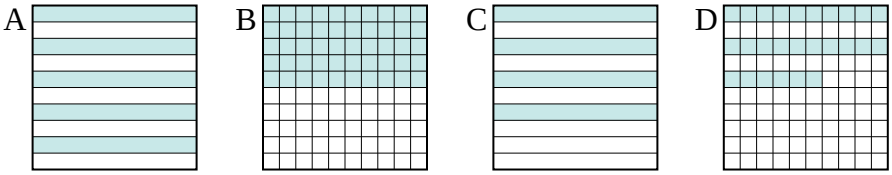

petite 0.26 - D
0.4 - C
0.5 - A
grande 0.5 - A

7)

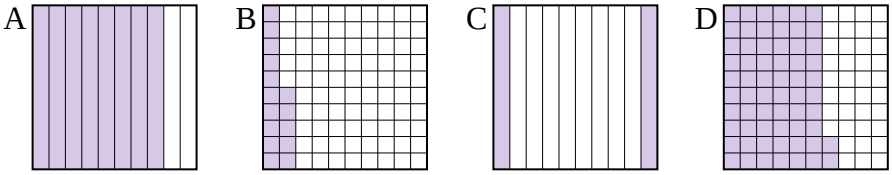

petite 0.15 - B
0.2 - C
0.62 - D
grande 0.8 - A

8)

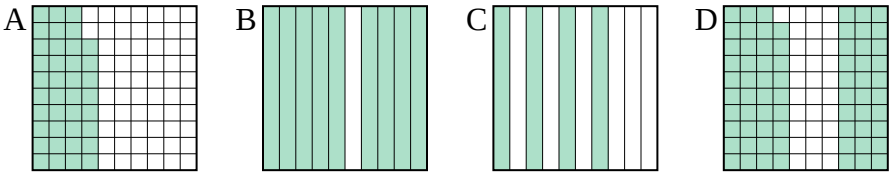

petite 0.38 - A
0.4 - C
0.69 - D
grande 0.9 - B

Réponses

Ex. **A,B,D,C**
1. **B,A,C,D**
2. **A,B,D,C**
3. **A,C,D,B**
4. **B,D,A,C**
5. **D,B,C,A**
6. **D,C,A,A**
7. **B,C,D,A**
8. **A,C,D,B**

1-8	88	75	63	50	38	25	13	0

Classement Visuel de Nombres Décimaux

Nom:

Classer les grilles, en fonction des zones colorées, de la plus petite à la plus grande.

Ex)

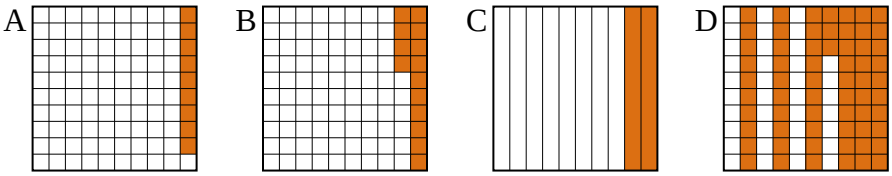

petite 0.09 - A
0.14 - B
0.2 - C
grande 0.63 - D

1)

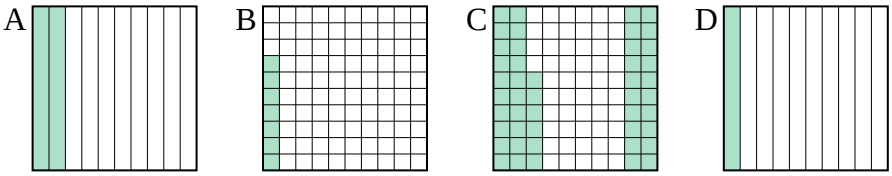

petite _____
_____
_____
grande _____

2)

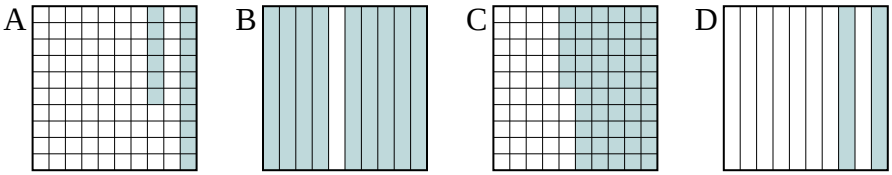

petite _____
_____
_____
grande _____

3)

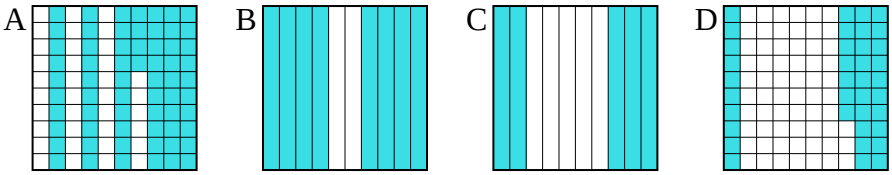

petite _____
_____
_____
grande _____

4)

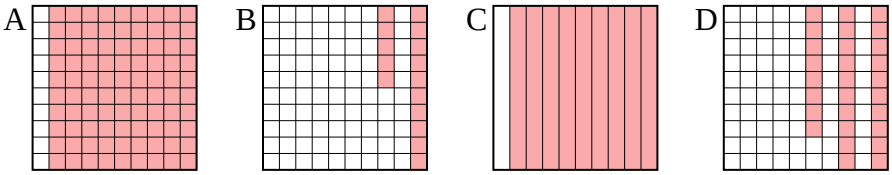

petite _____
_____
_____
grande _____

5)

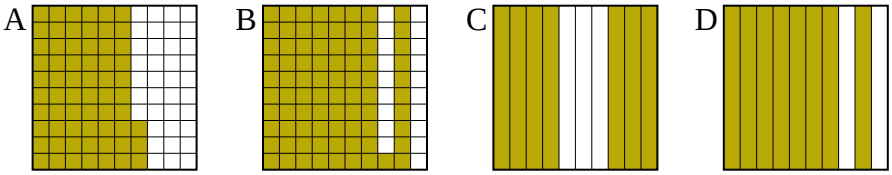

petite _____
_____
_____
grande _____

6)

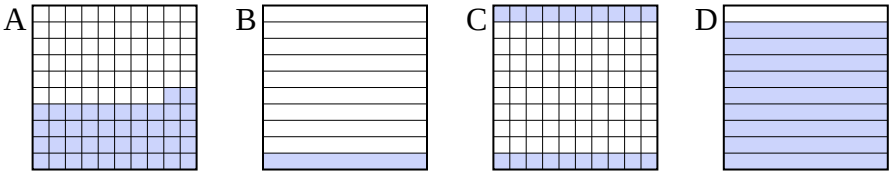

petite _____
_____
_____
grande _____

7)

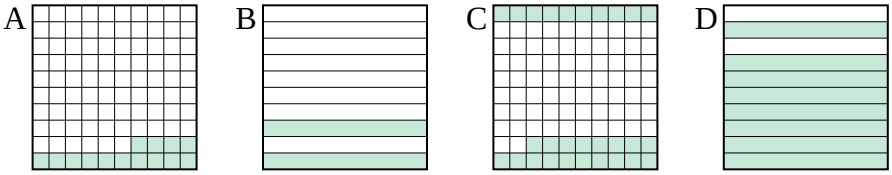

petite _____
_____
_____
grande _____

8)

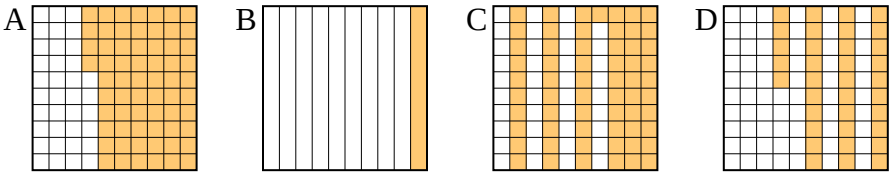

petite _____
_____
_____
grande _____

Réponses

Ex. **A,B,C,D**

1. _____
2. _____
3. _____
4. _____
5. _____
6. _____
7. _____
8. _____

1-8	88	75	63	50	38	25	13	0

Classement Visuel de Nombres Décimaux Nom: **Clé**

Classer les grilles, en fonction des zones colorées, de la plus petite à la plus grande.

Ex)

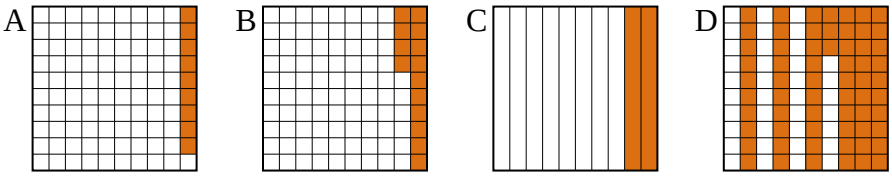

petite 0.09 - A
0.14 - B
0.2 - C
grande 0.63 - D

1)

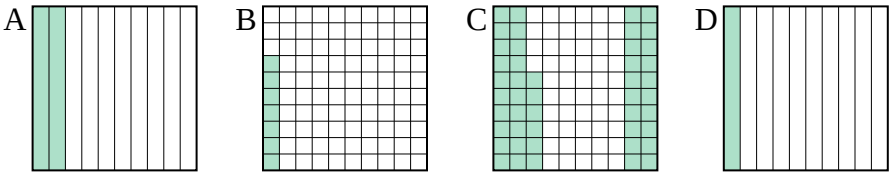

petite 0.07 - B
0.1 - D
0.2 - A
grande 0.46 - C

2)

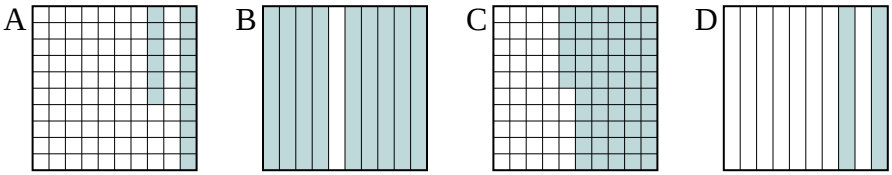

petite 0.16 - A
0.2 - D
0.55 - C
grande 0.9 - B

3)

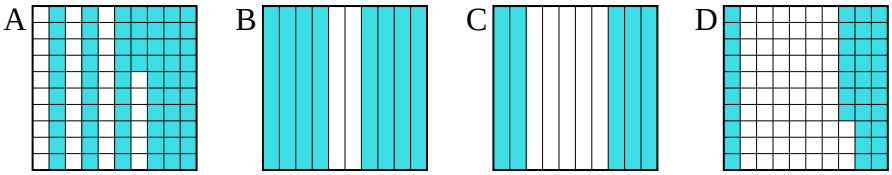

petite 0.37 - D
0.5 - C
0.64 - A
grande 0.8 - B

4)

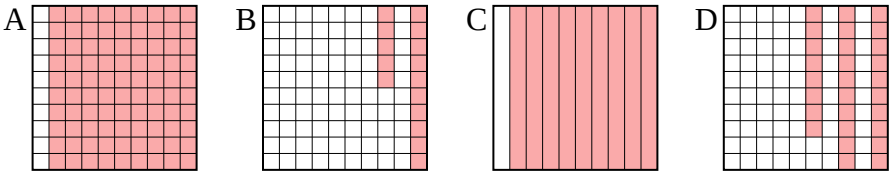

petite 0.15 - B
0.28 - D
0.9 - A
grande 0.9 - A

5)

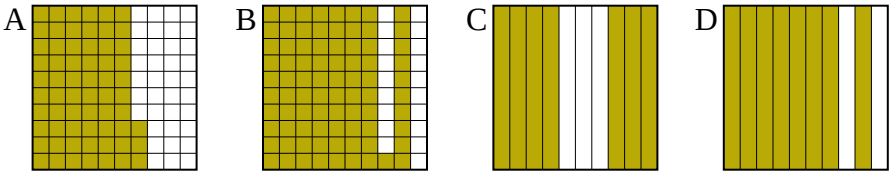

petite 0.63 - A
0.7 - C
0.8 - D
grande 0.81 - B

6)

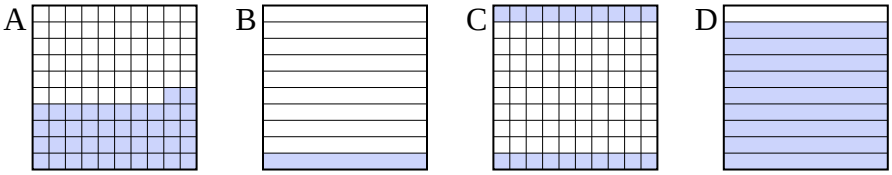

petite 0.1 - B
0.2 - C
0.42 - A
grande 0.9 - D

7)

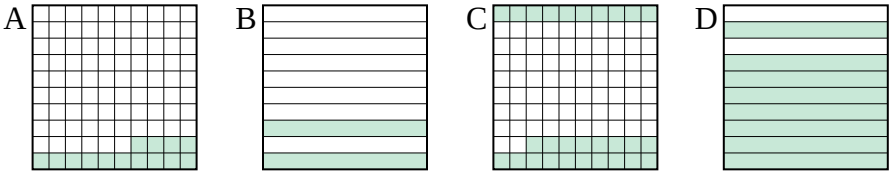

petite 0.14 - A
0.2 - B
0.28 - C
grande 0.8 - D

8)

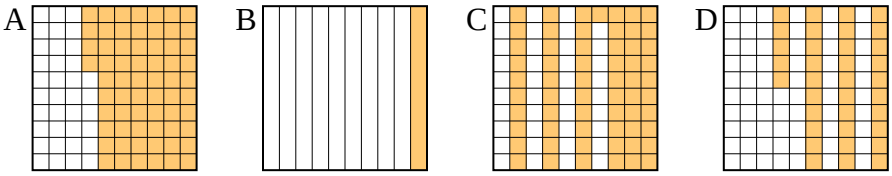

petite 0.1 - B
0.35 - D
0.61 - C
grande 0.64 - A

Réponses

Ex. **A,B,C,D**

1. **B,D,A,C**
2. **A,D,C,B**
3. **D,C,A,B**
4. **B,D,A,A**
5. **A,C,D,B**
6. **B,C,A,D**
7. **A,B,C,D**
8. **B,D,C,A**

1-8	88	75	63	50	38	25	13	0

Classement Visuel de Nombres Décimaux

Nom:

Classer les grilles, en fonction des zones colorées, de la plus petite à la plus grande.

Ex)

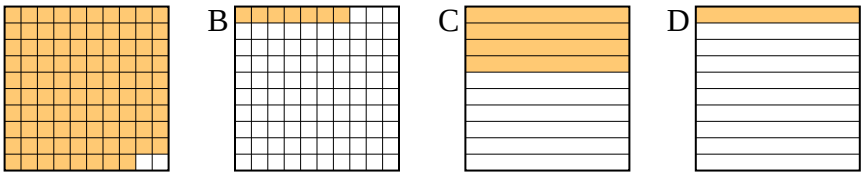

petite 0.07 - B
0.1 - D
0.4 - C
grande 0.98 - A

1)

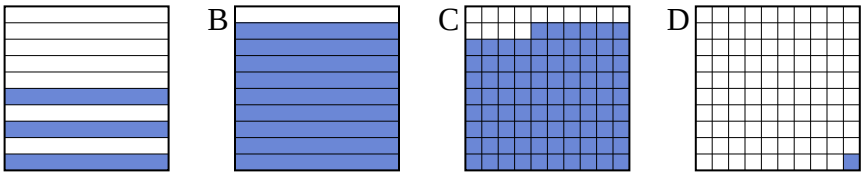

petite _____
_____
_____
grande _____

2)

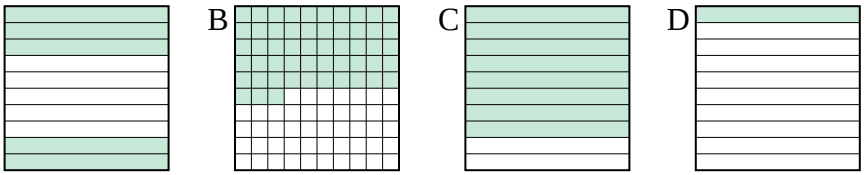

petite _____
_____
_____
grande _____

3)

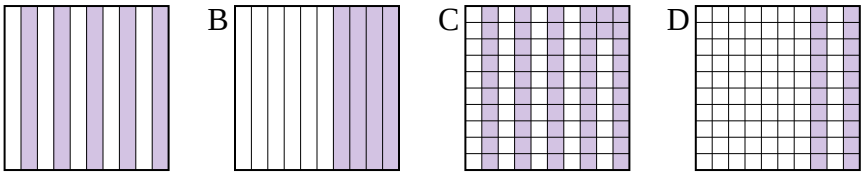

petite _____
_____
_____
grande _____

4)

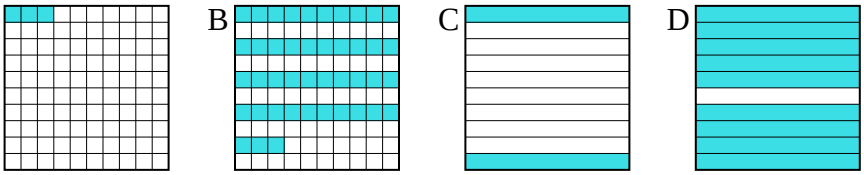

petite _____
_____
_____
grande _____

5)

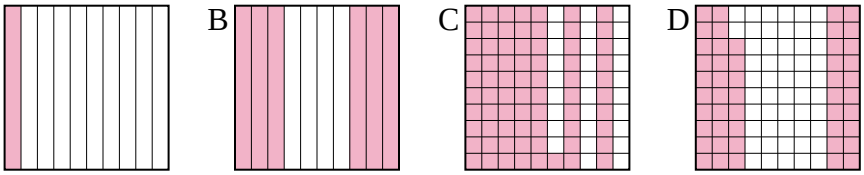

petite _____
_____
_____
grande _____

6)

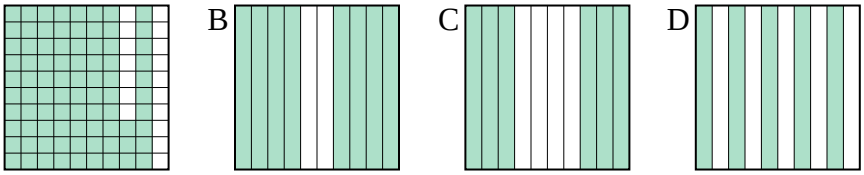

petite _____
_____
_____
grande _____

7)

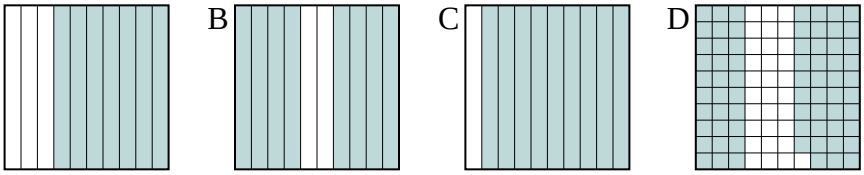

petite _____
_____
_____
grande _____

8)

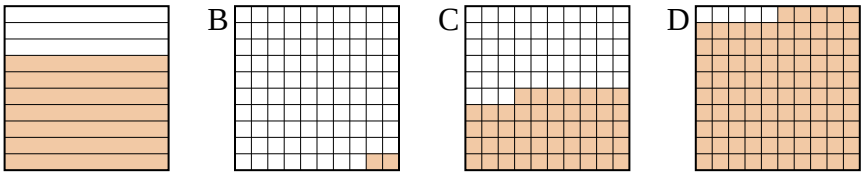

petite _____
_____
_____
grande _____

Réponses

Ex. **B,D,C,A**

1. _____
2. _____
3. _____
4. _____
5. _____
6. _____
7. _____
8. _____

1-8	88	75	63	50	38	25	13	0

Classement Visuel de Nombres Décimaux Nom: **Clé**

Classer les grilles, en fonction des zones colorées, de la plus petite à la plus grande.

Ex)

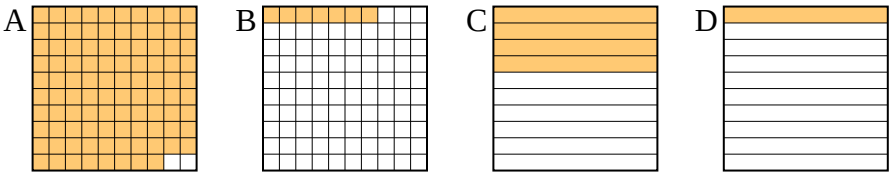

petite 0.07 - B
0.1 - D
0.4 - C
grande 0.98 - A

1)

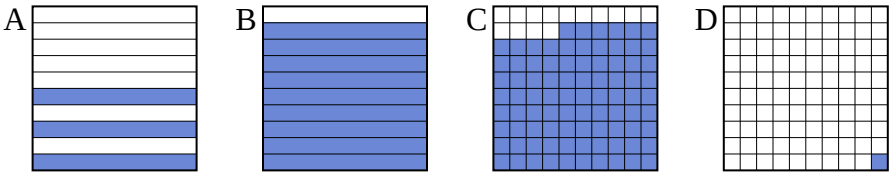

petite 0.01 - D
0.3 - A
0.86 - C
grande 0.9 - B

2)

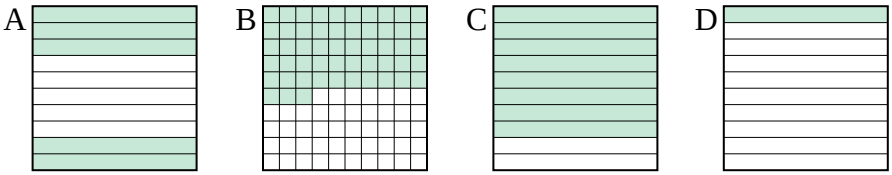

petite 0.1 - D
0.5 - A
0.53 - B
grande 0.8 - C

3)

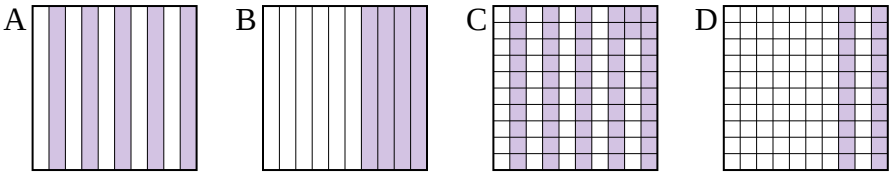

petite 0.2 - D
0.4 - B
0.5 - A
grande 0.52 - C

4)

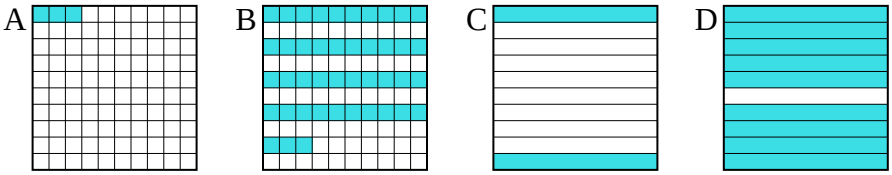

petite 0.03 - A
0.2 - C
0.43 - B
grande 0.9 - D

5)

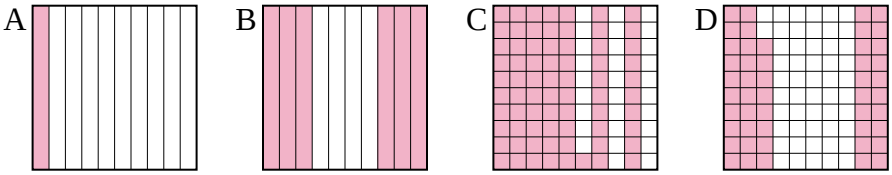

petite 0.1 - A
0.48 - D
0.6 - B
grande 0.71 - C

6)

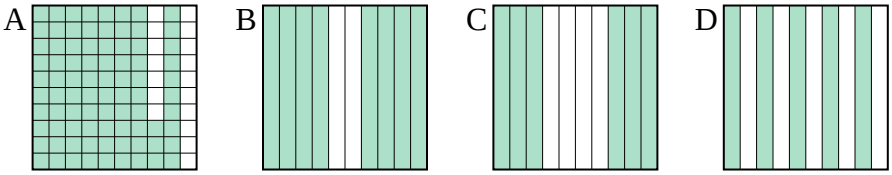

petite 0.5 - D
0.6 - C
0.8 - B
grande 0.83 - A

7)

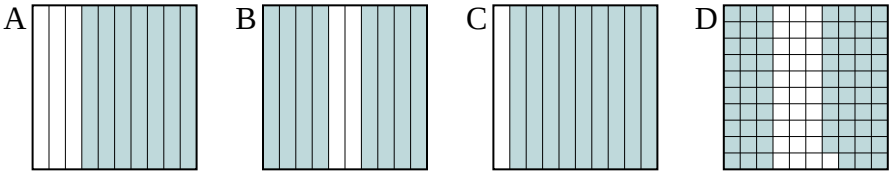

petite 0.69 - D
0.7 - A
0.8 - B
grande 0.9 - C

8)

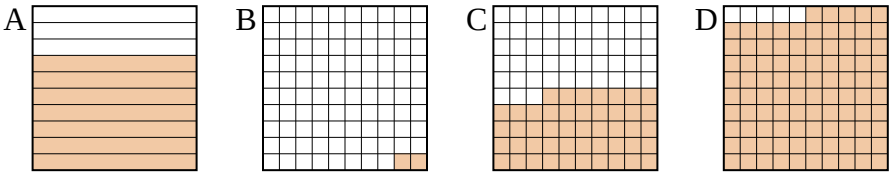

petite 0.02 - B
0.47 - C
0.7 - A
grande 0.95 - D

Réponses

Ex. **B,D,C,A**

1. **D,A,C,B**
2. **D,A,B,C**
3. **D,B,A,C**
4. **A,C,B,D**
5. **A,D,B,C**
6. **D,C,B,A**
7. **D,A,B,C**
8. **B,C,A,D**

Classement Visuel de Nombres Décimaux

Nom:

Classer les grilles, en fonction des zones colorées, de la plus petite à la plus grande.

Ex)

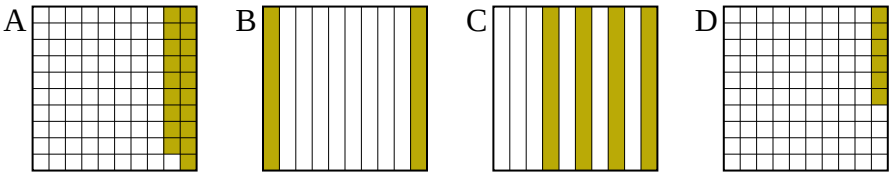

petite 0.06 - D
0.19 - A
0.2 - B
grande 0.4 - C

1)

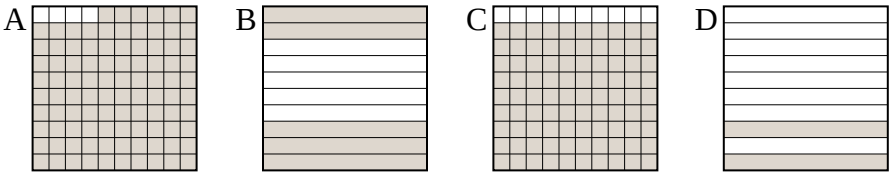

petite _____
_____
_____
grande _____

2)

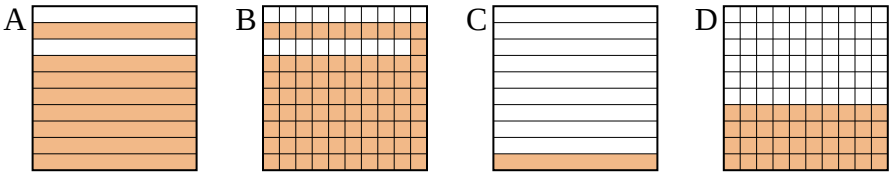

petite _____
_____
_____
grande _____

3)

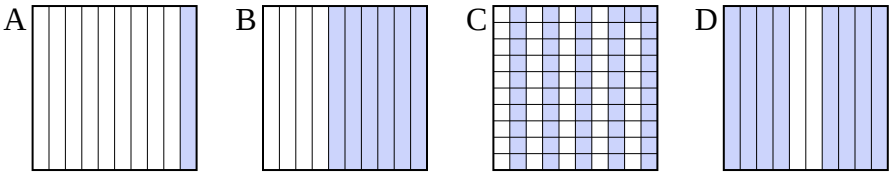

petite _____
_____
_____
grande _____

4)

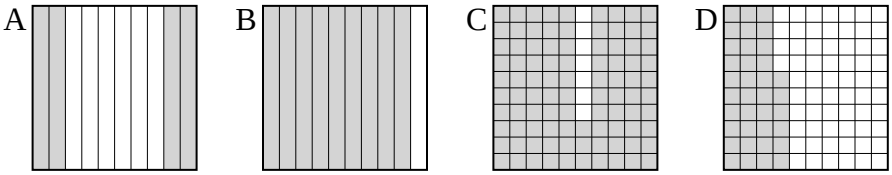

petite _____
_____
_____
grande _____

5)

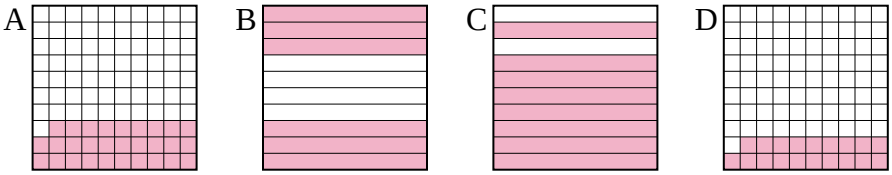

petite _____
_____
_____
grande _____

6)

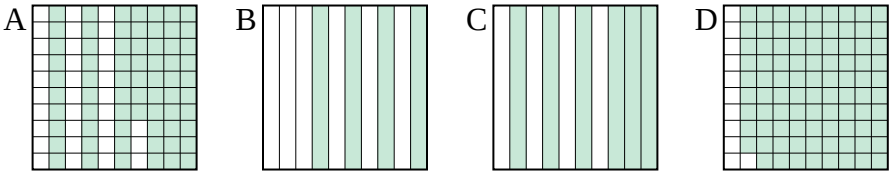

petite _____
_____
_____
grande _____

7)

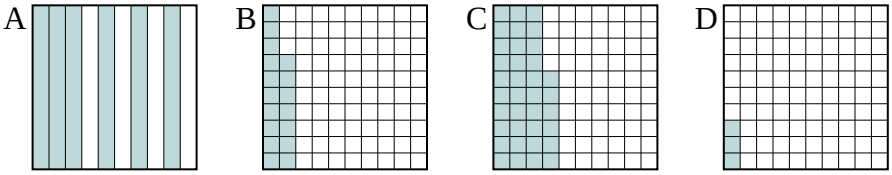

petite _____
_____
_____
grande _____

8)

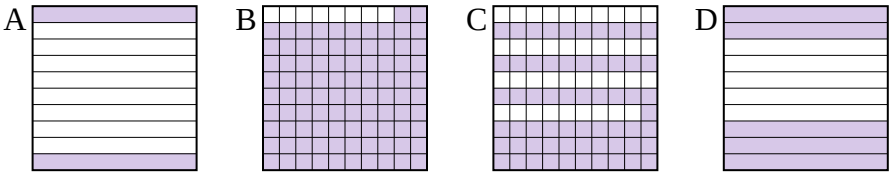

petite _____
_____
_____
grande _____

Réponses

Ex. **D,A,B,C**

1. _____
2. _____
3. _____
4. _____
5. _____
6. _____
7. _____
8. _____

1-8	88	75	63	50	38	25	13	0

Classement Visuel de Nombres Décimaux

Nom: **Clé**

Classer les grilles, en fonction des zones colorées, de la plus petite à la plus grande.

Ex)

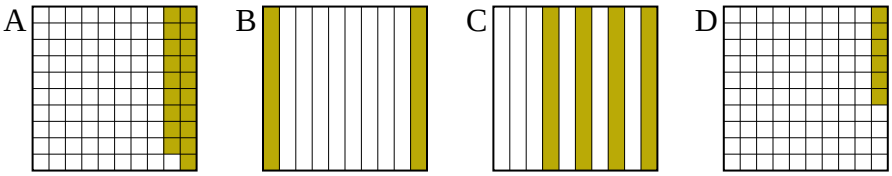

petite 0.06 - D
0.19 - A
0.2 - B
grande 0.4 - C

1)

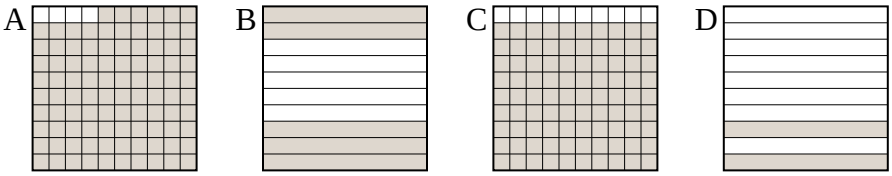

petite 0.2 - D
0.5 - B
0.9 - C
grande 0.96 - A

2)

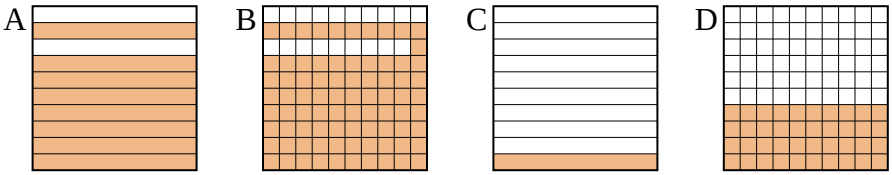

petite 0.1 - C
0.4 - D
0.8 - A
grande 0.81 - B

3)

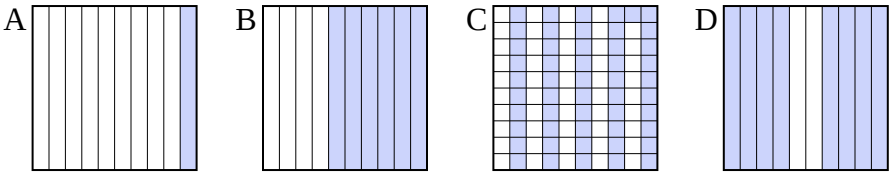

petite 0.1 - A
0.51 - C
0.6 - B
grande 0.8 - D

4)

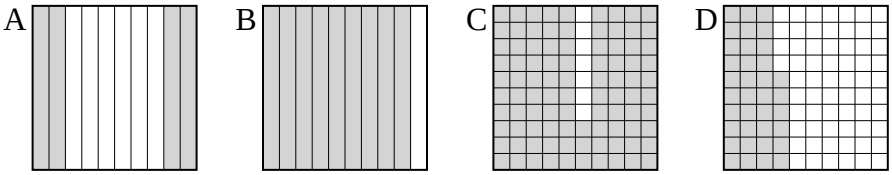

petite 0.36 - D
0.4 - A
0.9 - B
grande 0.93 - C

5)

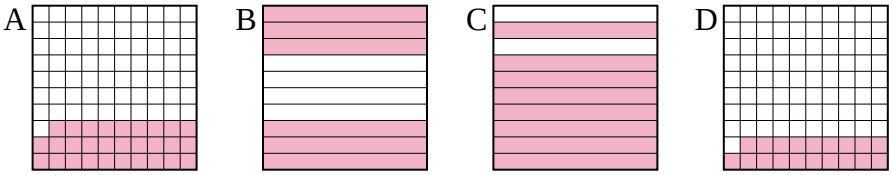

petite 0.19 - D
0.29 - A
0.6 - B
grande 0.8 - C

6)

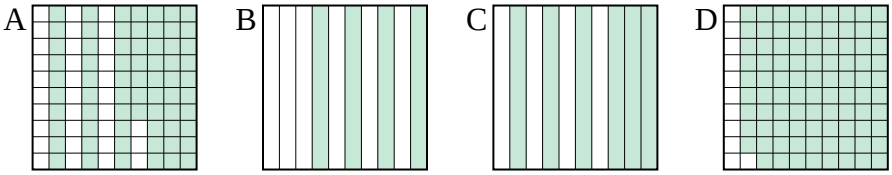

petite 0.4 - B
0.6 - C
0.67 - A
grande 0.89 - D

7)

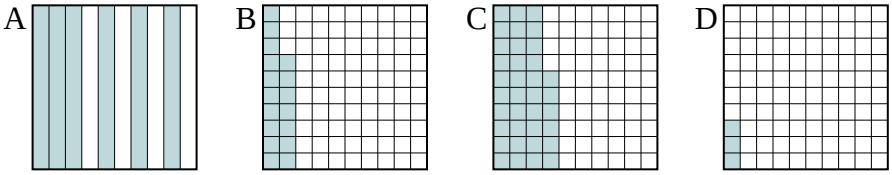

petite 0.03 - D
0.17 - B
0.36 - C
grande 0.6 - A

8)

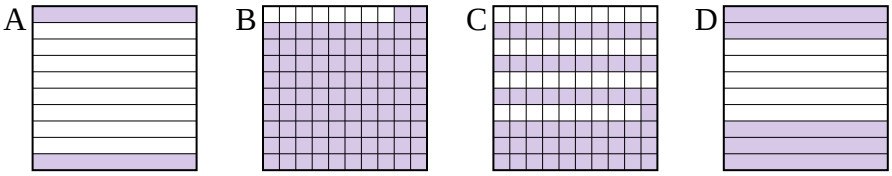

petite 0.2 - A
0.5 - D
0.61 - C
grande 0.92 - B

Réponses

Ex.	D,A,B,C
1.	D,B,C,A
2.	C,D,A,B
3.	A,C,B,D
4.	D,A,B,C
5.	D,A,B,C
6.	B,C,A,D
7.	D,B,C,A
8.	A,D,C,B

1-8	88	75	63	50	38	25	13	0

Classement Visuel de Nombres Décimaux

Nom:

Classer les grilles, en fonction des zones colorées, de la plus petite à la plus grande.

Ex)

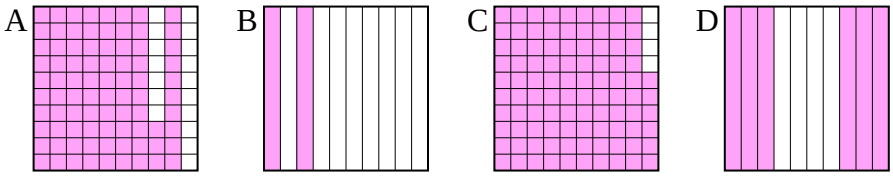

petite 0.2 - B
0.6 - D
0.83 - A
grande 0.96 - C

1)

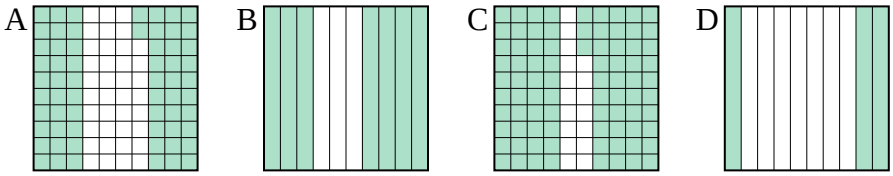

petite _____
_____
_____
grande _____

2)

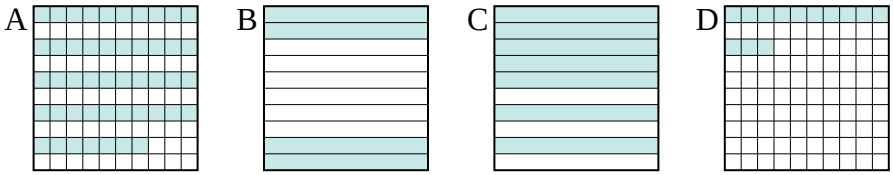

petite _____
_____
_____
grande _____

3)

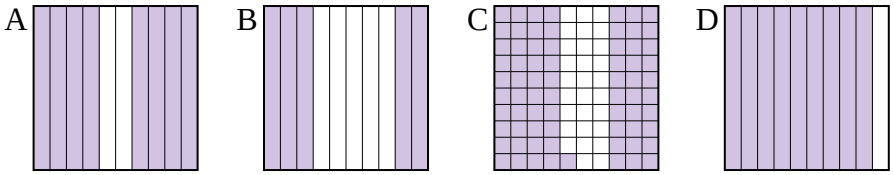

petite _____
_____
_____
grande _____

4)

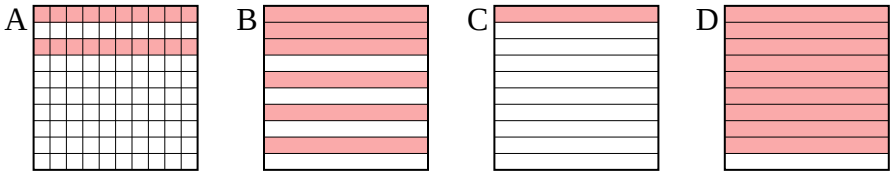

petite _____
_____
_____
grande _____

5)

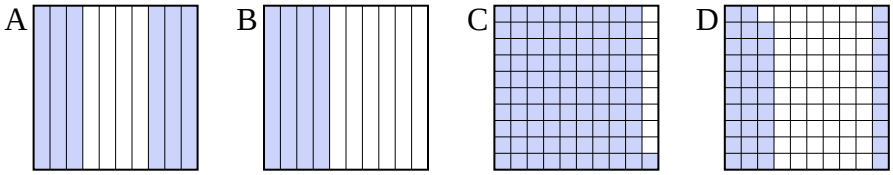

petite _____
_____
_____
grande _____

6)

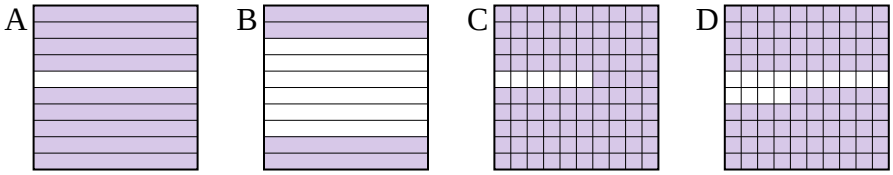

petite _____
_____
_____
grande _____

7)

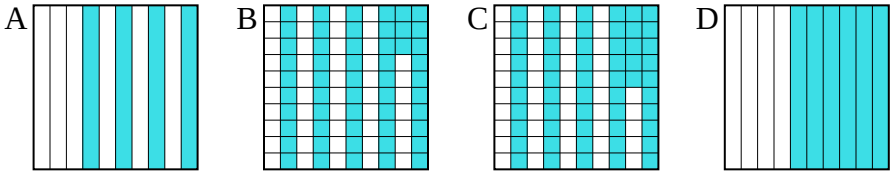

petite _____
_____
_____
grande _____

8)

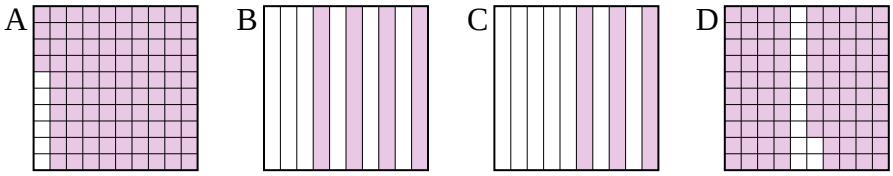

petite _____
_____
_____
grande _____

Réponses

Ex. **B,D,A,C**

1. _____
2. _____
3. _____
4. _____
5. _____
6. _____
7. _____
8. _____

1-8	88	75	63	50	38	25	13	0

Classement Visuel de Nombres Décimaux Nom: **Clé**

Classer les grilles, en fonction des zones colorées, de la plus petite à la plus grande.

Ex)

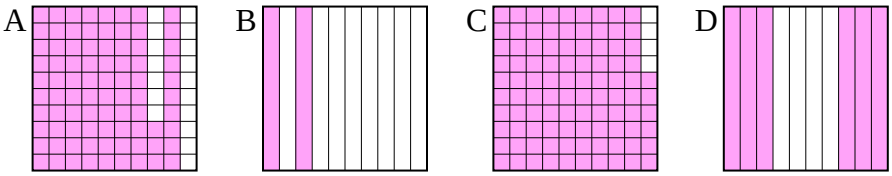

petite 0.2 - B
0.6 - D
0.83 - A
grande 0.96 - C

1)

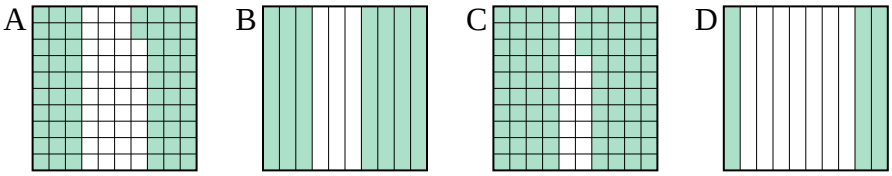

petite 0.3 - D
0.62 - A
0.7 - B
grande 0.83 - C

2)

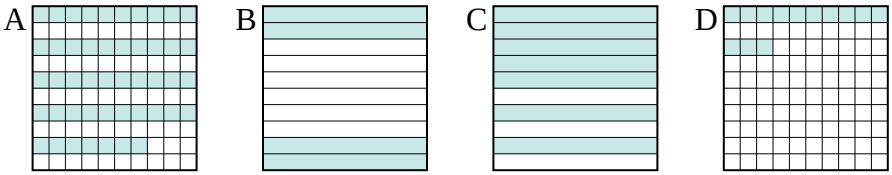

petite 0.13 - D
0.4 - B
0.47 - A
grande 0.7 - C

3)

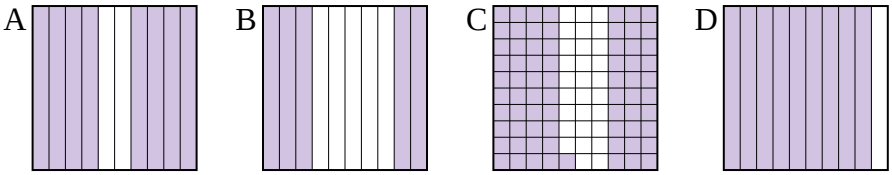

petite 0.5 - B
0.71 - C
0.8 - A
grande 0.9 - D

4)

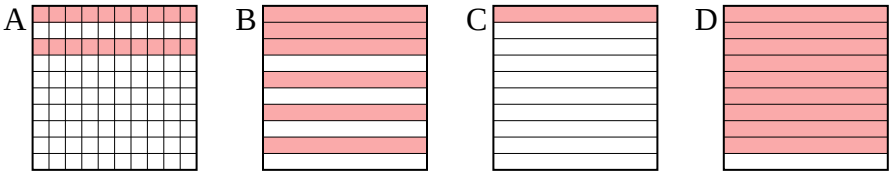

petite 0.1 - C
0.2 - A
0.6 - B
grande 0.9 - D

5)

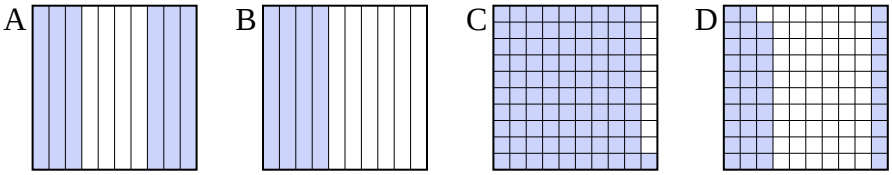

petite 0.39 - D
0.4 - B
0.6 - A
grande 0.91 - C

6)

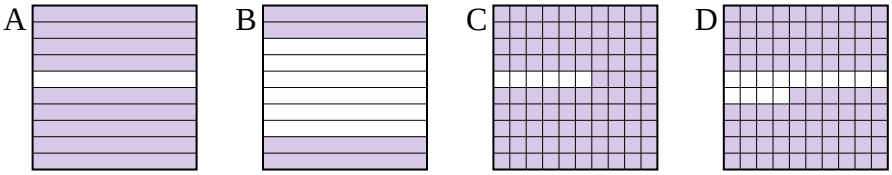

petite 0.4 - B
0.86 - D
0.9 - A
grande 0.94 - C

7)

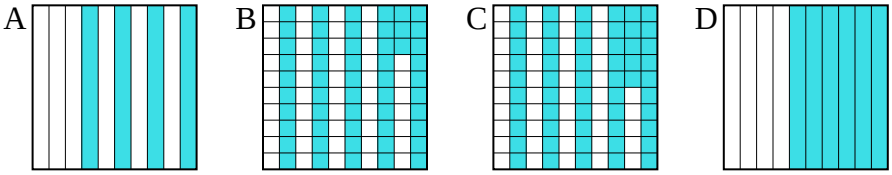

petite 0.4 - A
0.53 - B
0.55 - C
grande 0.6 - D

8)

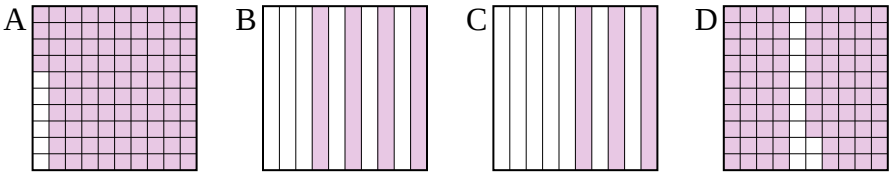

petite 0.3 - C
0.4 - B
0.88 - D
grande 0.94 - A

Réponses

Ex. **B,D,A,C**

1. **D,A,B,C**
2. **D,B,A,C**
3. **B,C,A,D**
4. **C,A,B,D**
5. **D,B,A,C**
6. **B,D,A,C**
7. **A,B,C,D**
8. **C,B,D,A**

1-8	88	75	63	50	38	25	13	0

Classement Visuel de Nombres Décimaux

Nom:

Classer les grilles, en fonction des zones colorées, de la plus petite à la plus grande.

Ex)

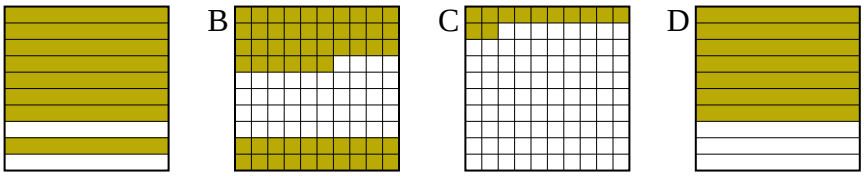

petite 0.12 - C
0.56 - B
0.7 - D
grande 0.8 - A

1)

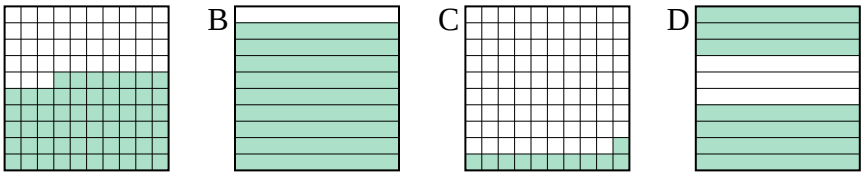

petite _____
_____
_____
grande _____

2)

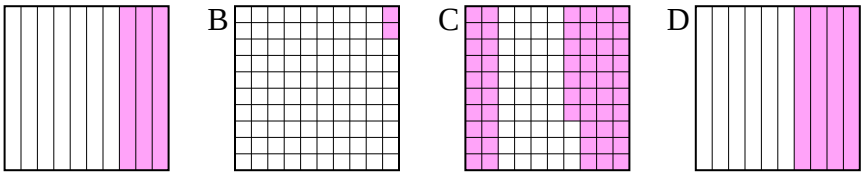

petite _____
_____
_____
grande _____

3)

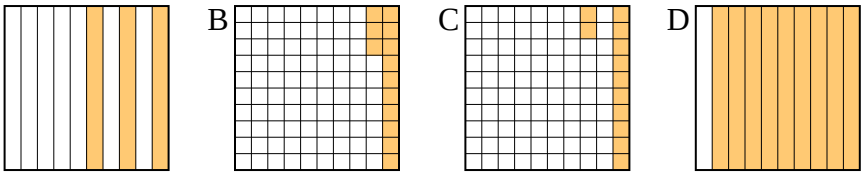

petite _____
_____
_____
grande _____

4)

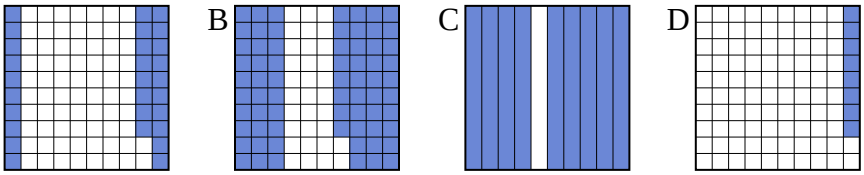

petite _____
_____
_____
grande _____

5)

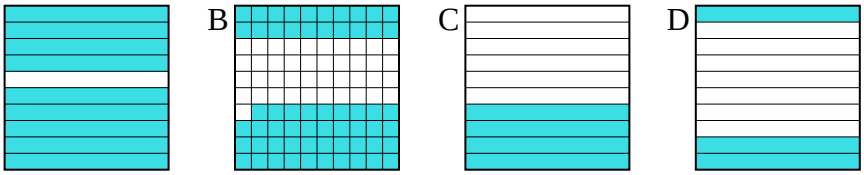

petite _____
_____
_____
grande _____

6)

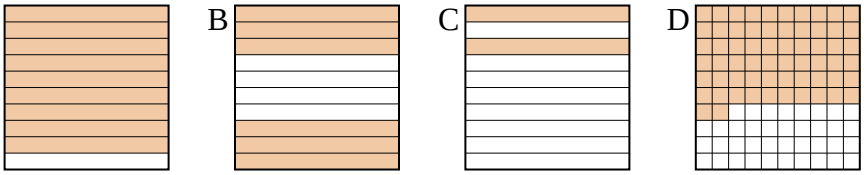

petite _____
_____
_____
grande _____

7)

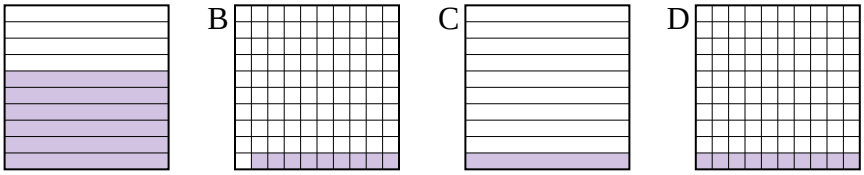

petite _____
_____
_____
grande _____

8)

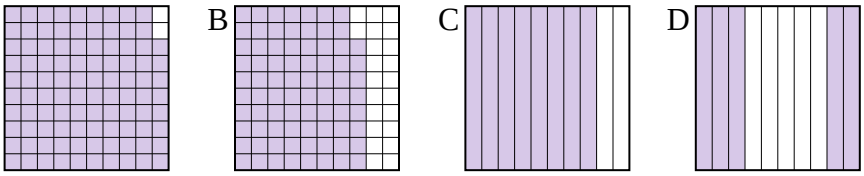

petite _____
_____
_____
grande _____

Réponses

Ex. **C,B,D,A**

1. _____
2. _____
3. _____
4. _____
5. _____
6. _____
7. _____
8. _____

1-8	88	75	63	50	38	25	13	0

Classement Visuel de Nombres Décimaux Nom: **Clé**

Classer les grilles, en fonction des zones colorées, de la plus petite à la plus grande.

Ex)

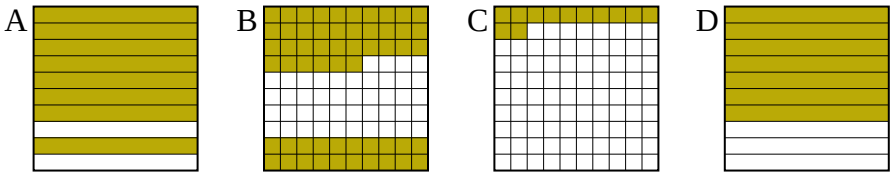

petite 0.12 - C
0.56 - B
0.7 - D
grande 0.8 - A

1)

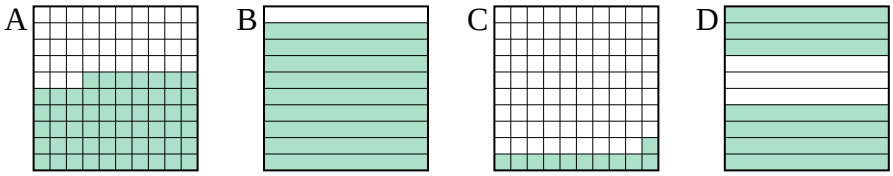

petite 0.11 - C
0.57 - A
0.7 - D
grande 0.9 - B

2)

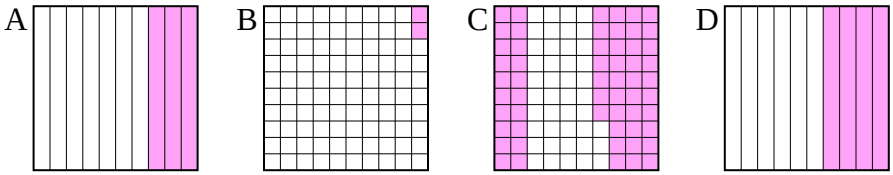

petite 0.02 - B
0.3 - A
0.4 - D
grande 0.57 - C

3)

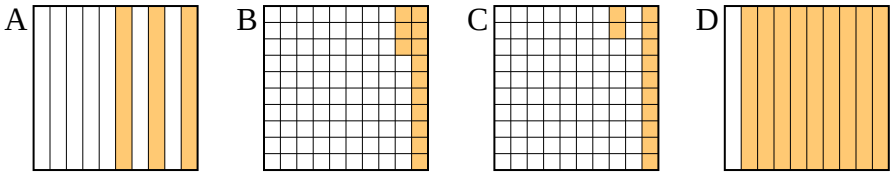

petite 0.12 - C
0.13 - B
0.3 - A
grande 0.9 - D

4)

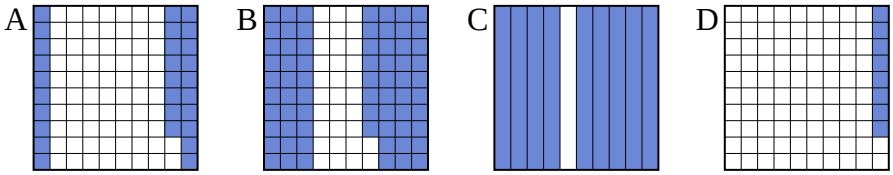

petite 0.08 - D
0.28 - A
0.68 - B
grande 0.9 - C

5)

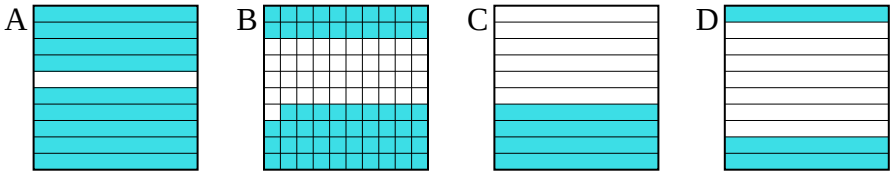

petite 0.3 - D
0.4 - C
0.59 - B
grande 0.9 - A

6)

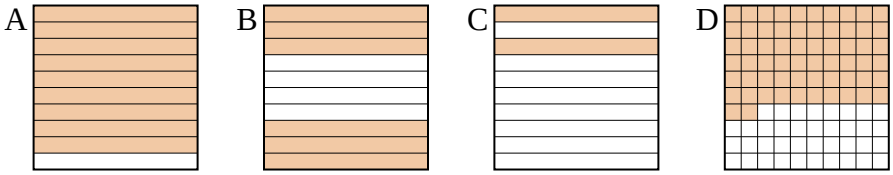

petite 0.2 - C
0.6 - B
0.62 - D
grande 0.9 - A

7)

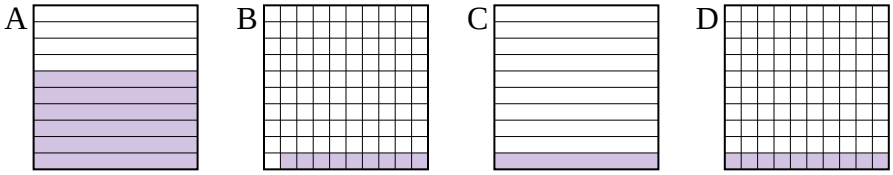

petite 0.09 - B
0.1 - C
0.1 - C
grande 0.6 - A

8)

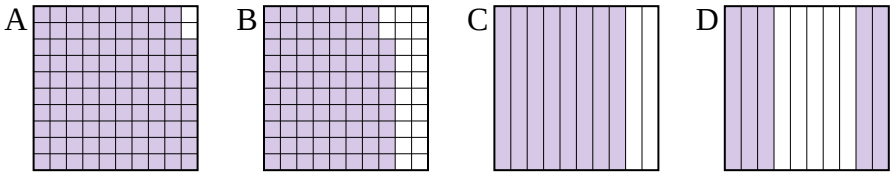

petite 0.5 - D
0.78 - B
0.8 - C
grande 0.98 - A

Réponses

Ex.	C,B,D,A
1.	C,A,D,B
2.	B,A,D,C
3.	C,B,A,D
4.	D,A,B,C
5.	D,C,B,A
6.	C,B,D,A
7.	B,C,C,A
8.	D,B,C,A

1-8	88	75	63	50	38	25	13	0

Classement Visuel de Nombres Décimaux

Nom:

Classer les grilles, en fonction des zones colorées, de la plus petite à la plus grande.

Ex)

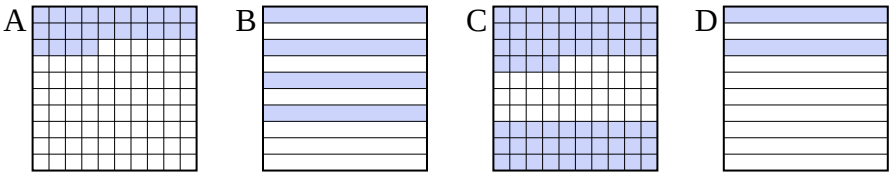

petite 0.2 - D
0.24 - A
0.4 - B
grande 0.64 - C

1)

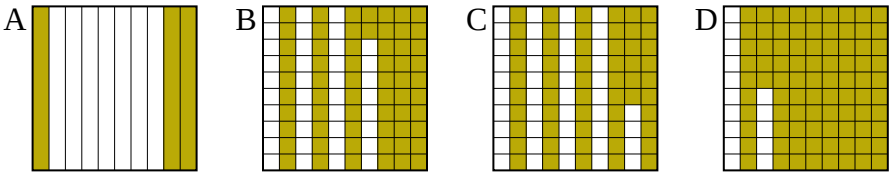

petite _____
_____
_____
grande _____

2)

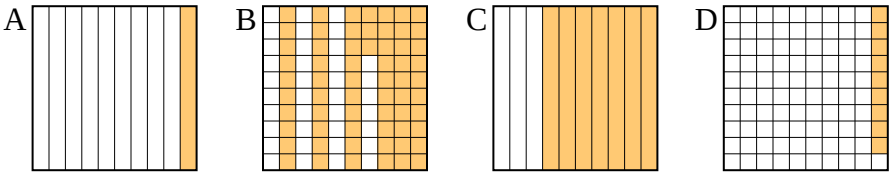

petite _____
_____
_____
grande _____

3)

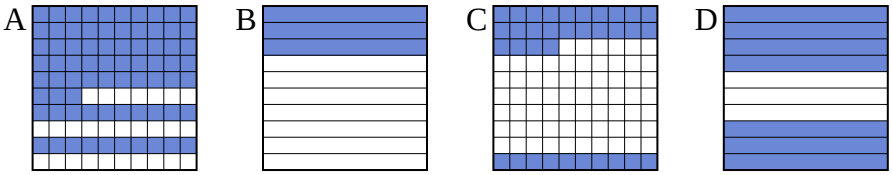

petite _____
_____
_____
grande _____

4)

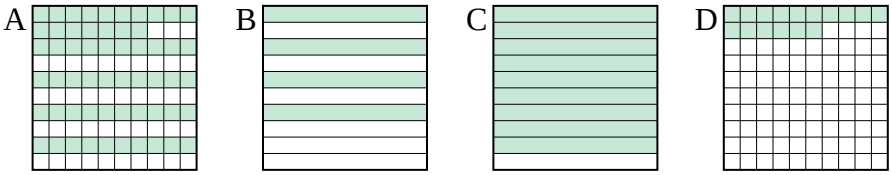

petite _____
_____
_____
grande _____

5)

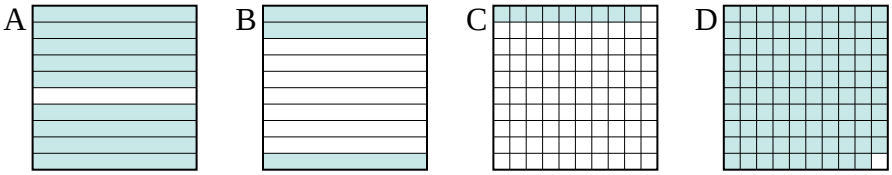

petite _____
_____
_____
grande _____

6)

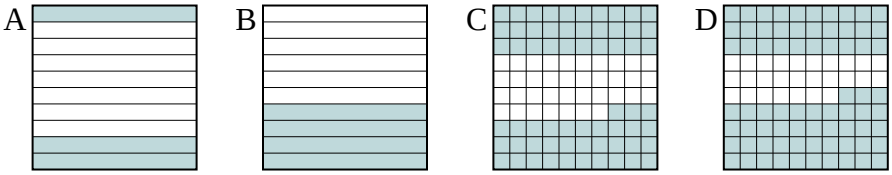

petite _____
_____
_____
grande _____

7)

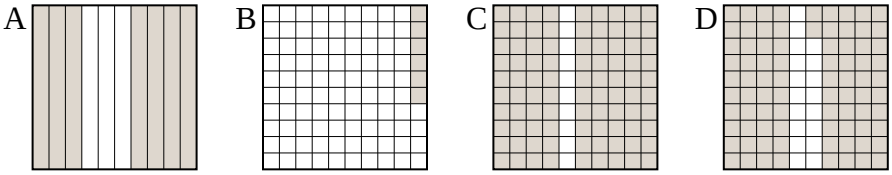

petite _____
_____
_____
grande _____

8)

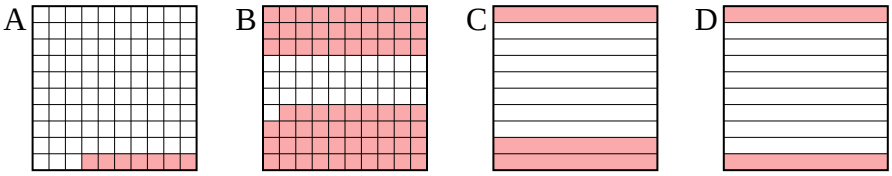

petite _____
_____
_____
grande _____

Réponses

Ex. **D,A,B,C**

1. _____
2. _____
3. _____
4. _____
5. _____
6. _____
7. _____
8. _____

1-8	88	75	63	50	38	25	13	0

Classement Visuel de Nombres Décimaux Nom: **Clé**

Classer les grilles, en fonction des zones colorées, de la plus petite à la plus grande.

Ex)

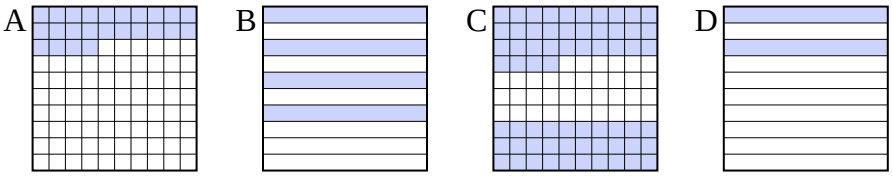

petite 0.2 - D
0.24 - A
0.4 - B
grande 0.64 - C

1)

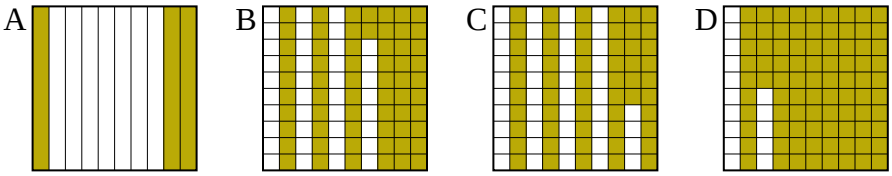

petite 0.3 - A
0.56 - C
0.62 - B
grande 0.85 - D

2)

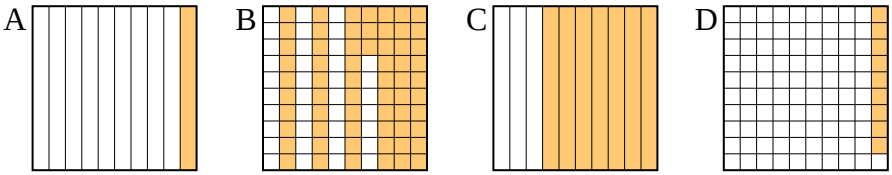

petite 0.09 - D
0.1 - A
0.63 - B
grande 0.7 - C

3)

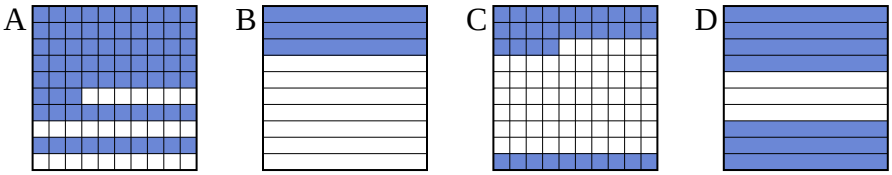

petite 0.3 - B
0.34 - C
0.7 - D
grande 0.73 - A

4)

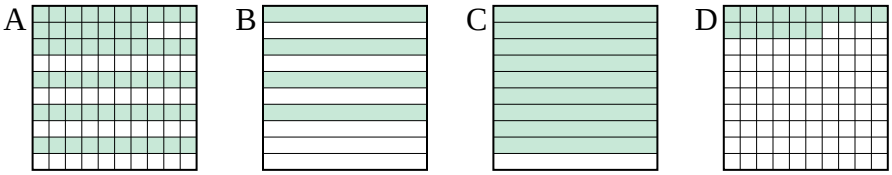

petite 0.16 - D
0.4 - B
0.57 - A
grande 0.9 - C

5)

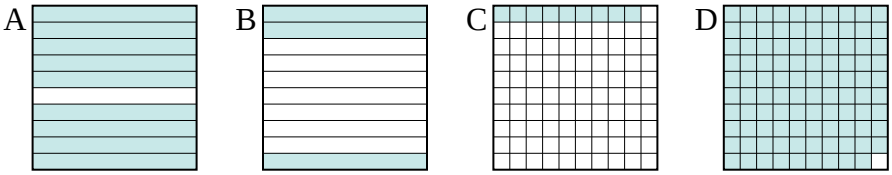

petite 0.09 - C
0.3 - B
0.9 - A
grande 0.99 - D

6)

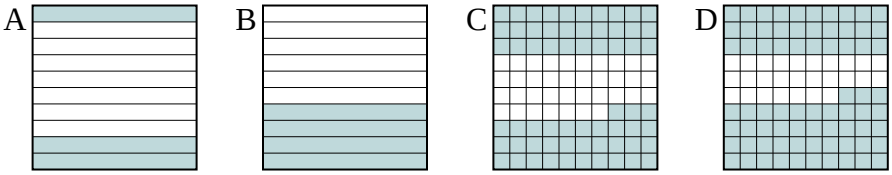

petite 0.3 - A
0.4 - B
0.63 - C
grande 0.73 - D

7)

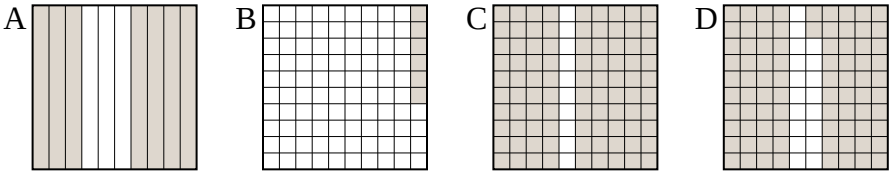

petite 0.06 - B
0.7 - A
0.82 - D
grande 0.9 - C

8)

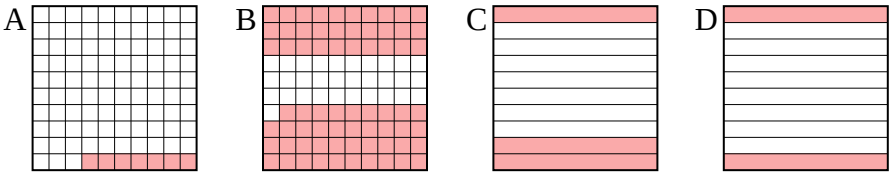

petite 0.07 - A
0.2 - D
0.3 - C
grande 0.69 - B

Réponses

Ex. **D,A,B,C**

1. **A,C,B,D**
2. **D,A,B,C**
3. **B,C,D,A**
4. **D,B,A,C**
5. **C,B,A,D**
6. **A,B,C,D**
7. **B,A,D,C**
8. **A,D,C,B**

1-8	88	75	63	50	38	25	13	0