Exprimer des fractions sous forme de mots Nom:

Écrivez le montant ombré sous forme de mot.

Ex)

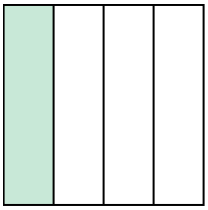

1)

2)

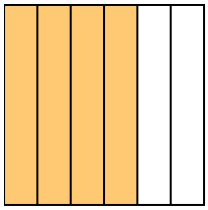

3)

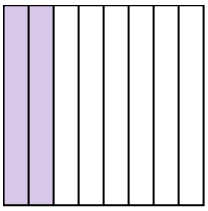

4)

5)

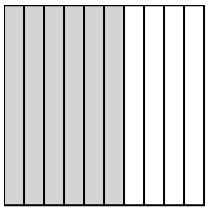

6)

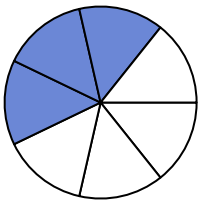

7)

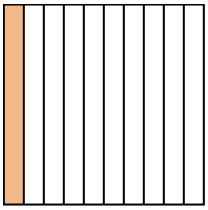

8)

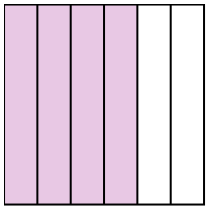

9)

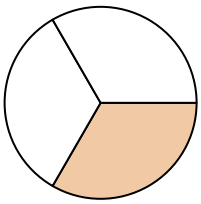

10)



11)

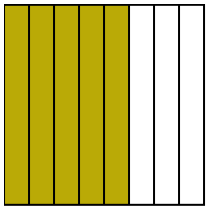

12)

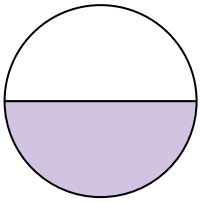

13)

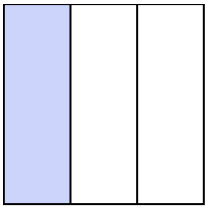

14)



Réponses

Ex. un quart

1. _____
2. _____
3. _____
4. _____
5. _____
6. _____
7. _____
8. _____
9. _____
10. _____
11. _____
12. _____
13. _____
14. _____

1-10	93	86	79	71	64	57	50	43	36	29
11-14	21	14	7	0						

Exprimer des fractions sous forme de mots Nom: **Clé**

Écrivez le montant ombré sous forme de mot.

Ex)

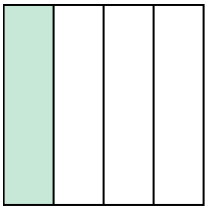

1)

2)

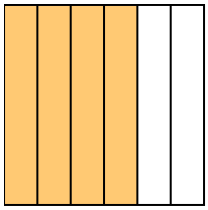

3)

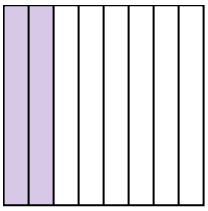

4)

5)

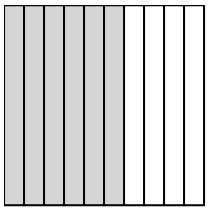

6)

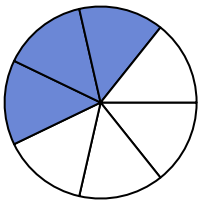

7)

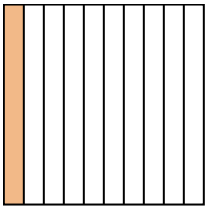

8)

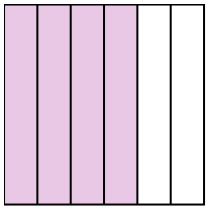

9)

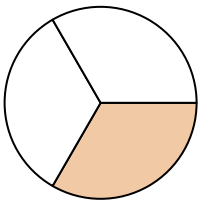

10)



11)

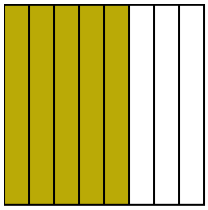

12)

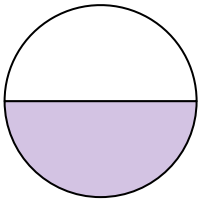

13)

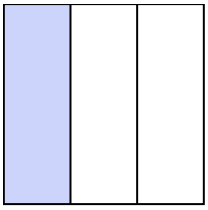

14)



Réponses

Ex. un quart

1. deux cinquièmes
2. quatre sixièmes
3. deux huitièmes
4. sept neuvièmes
5. six dixièmes
6. trois-septièmes
7. un dixième
8. quatre sixièmes
9. un tiers
10. une moitié
11. cinq huitièmes
12. une moitié
13. un tiers
14. un quart

1-10	93	86	79	71	64	57	50	43	36	29
11-14	21	14	7	0						