Exprimer des fractions sous forme de mots Nom:

**Écrivez le montant ombré sous forme de mot.**

**Ex)**



**1)**

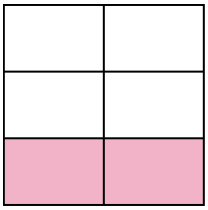

**2)**



**3)**

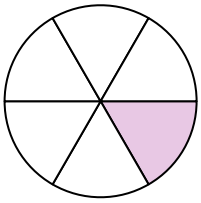

**4)**

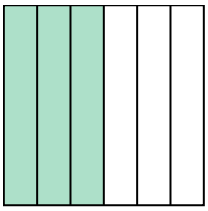

**5)**

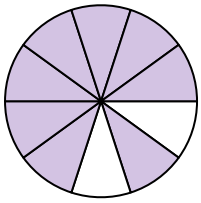

**6)**

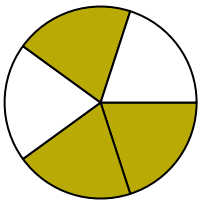

**7)**

**8)**

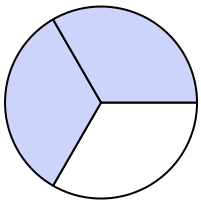

**9)**

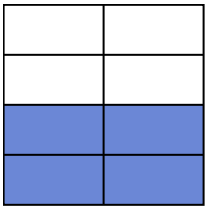

**10)**

**11)**



**12)**



**13)**



**14)**

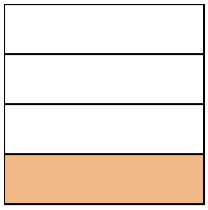

## Réponses

Ex. **une moitié**

1. _____
2. _____
3. _____
4. _____
5. _____
6. _____
7. _____
8. _____
9. _____
10. _____
11. _____
12. _____
13. _____
14. _____



| | | | | | | | | | | |
|---|---|---|---|---|---|---|---|---|---|---|
| 1-10 | 93 | 86 | 79 | 71 | 64 | 57 | 50 | 43 | 36 | 29 |
| 11-14 | 21 | 14 | 7 | 0 | | | | | | |

Exprimer des fractions sous forme de mots Nom: **Clé**

**Écrivez le montant ombré sous forme de mot.**

**Ex)**



**1)**

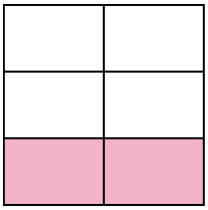

**2)**



**3)**

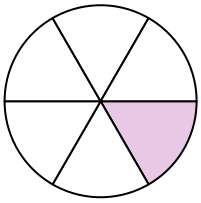

**4)**

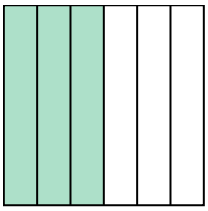

**5)**

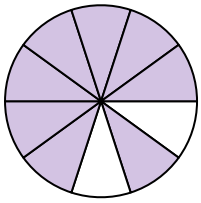

**6)**

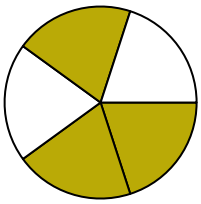

**7)**

**8)**

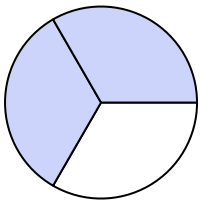

**9)**

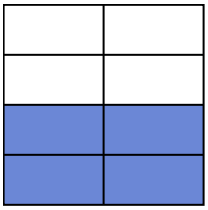

**10)**

**11)**



**12)**



**13)**



**14)**

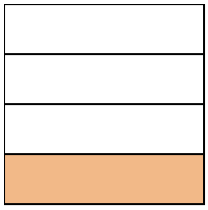

## Réponses

Ex. **une moitié**

1. **deux cinquièmes**
2. **deux neuvièmes**
3. **un sixième**
4. **trois sixièmes**
5. **huit dixièmes**
6. **les trois cinquièmes**
7. **trois quarts**
8. **les deux tiers**
9. **quatre septièmes**
10. **un dixième**
11. **les deux tiers**
12. **quatre huitièmes**
13. **une moitié**
14. **un quart**



| | | | | | | | | | | |
|---|---|---|---|---|---|---|---|---|---|---|
| 1-10 | 93 | 86 | 79 | 71 | 64 | 57 | 50 | 43 | 36 | 29 |
| 11-14 | 21 | 14 | 7 | 0 | | | | | | |

Exprimer des fractions sous forme de mots Nom:

**Écrivez le montant ombré sous forme de mot.**

**Ex)**

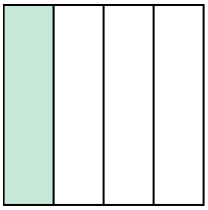

**1)**

**2)**

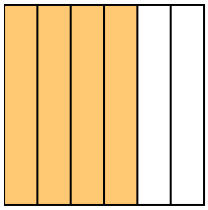

**3)**

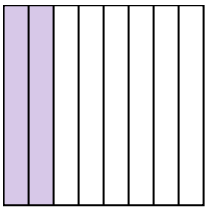

**4)**

**5)**

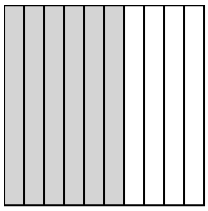

**6)**

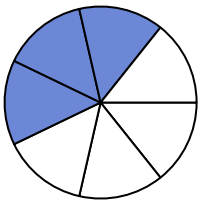

**7)**

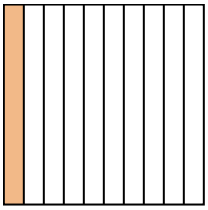

**8)**

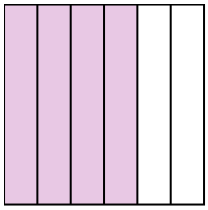

**9)**

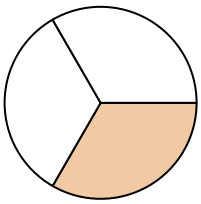

**10)**



**11)**

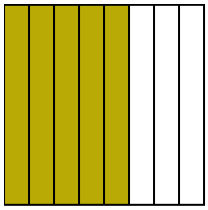

**12)**

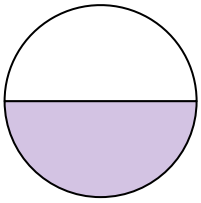

**13)**

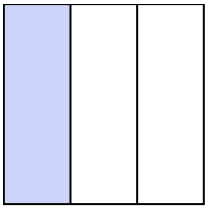

**14)**



## Réponses

Ex. un quart

1. _____
2. _____
3. _____
4. _____
5. _____
6. _____
7. _____
8. _____
9. _____
10. _____
11. _____
12. _____
13. _____
14. _____



| | | | | | | | | | | |
|---|---|---|---|---|---|---|---|---|---|---|
| 1-10 | 93 | 86 | 79 | 71 | 64 | 57 | 50 | 43 | 36 | 29 |
| 11-14 | 21 | 14 | 7 | 0 | | | | | | |

Exprimer des fractions sous forme de mots Nom: **Clé**

**Écrivez le montant ombré sous forme de mot.**

**Ex)**

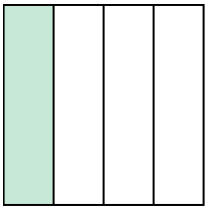

**1)**

**2)**

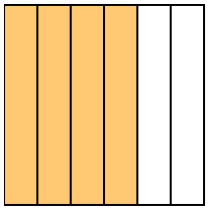

**3)**

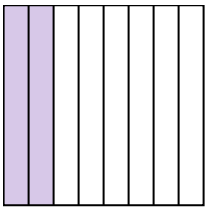

**4)**

**5)**

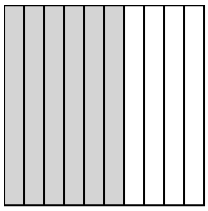

**6)**

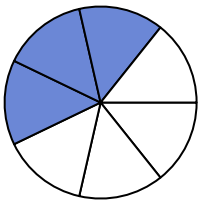

**7)**

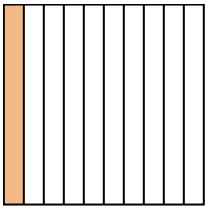

**8)**

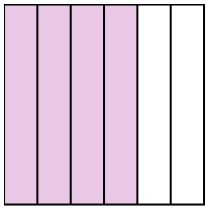

**9)**

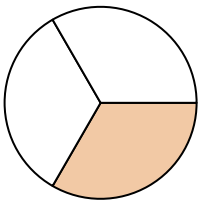

**10)**



**11)**

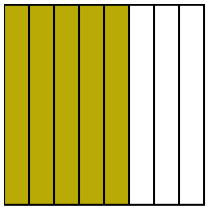

**12)**

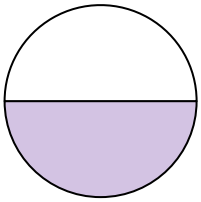

**13)**

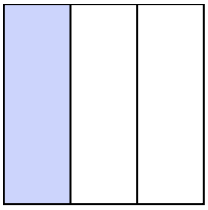

**14)**



## Réponses

Ex. un quart

1. deux cinquièmes
2. quatre sixièmes
3. deux huitièmes
4. sept neuvièmes
5. six dixièmes
6. trois-septièmes
7. un dixième
8. quatre sixièmes
9. un tiers
10. une moitié
11. cinq huitièmes
12. une moitié
13. un tiers
14. un quart



| | | | | | | | | | | |
|---|---|---|---|---|---|---|---|---|---|---|
| 1-10 | 93 | 86 | 79 | 71 | 64 | 57 | 50 | 43 | 36 | 29 |
| 11-14 | 21 | 14 | 7 | 0 | | | | | | |

Exprimer des fractions sous forme de mots Nom:

**Écrivez le montant ombré sous forme de mot.**

**Ex)**

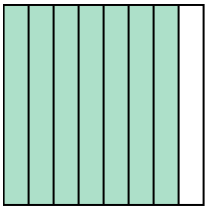

**1)**

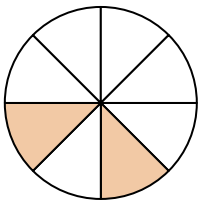

**2)**

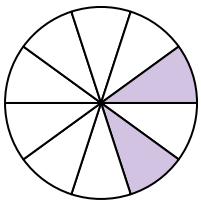

**3)**

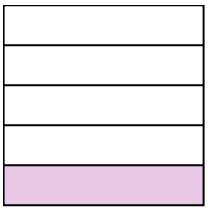

**4)**



**5)**

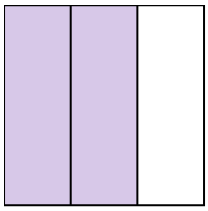

**6)**

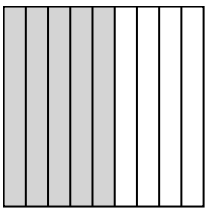

**7)**

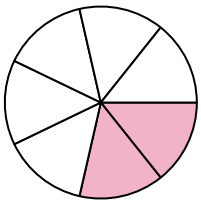

**8)**



**9)**



**10)**

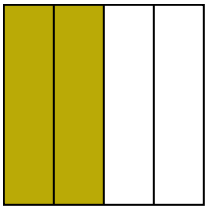

**11)**



**12)**



**13)**

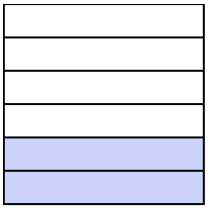

**14)**

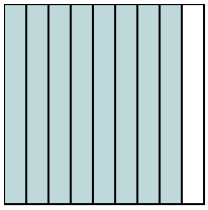

## Réponses

Ex. sept huitièmes

1. _____
2. _____
3. _____
4. _____
5. _____
6. _____
7. _____
8. _____
9. _____
10. _____
11. _____
12. _____
13. _____
14. _____



| | | | | | | | | | | |
|---|---|---|---|---|---|---|---|---|---|---|
| 1-10 | 93 | 86 | 79 | 71 | 64 | 57 | 50 | 43 | 36 | 29 |
| 11-14 | 21 | 14 | 7 | 0 | | | | | | |

Exprimer des fractions sous forme de mots Nom: **Clé**

**Écrivez le montant ombré sous forme de mot.**

**Ex)**

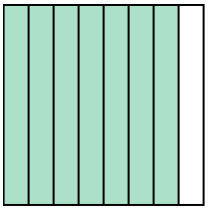

**1)**

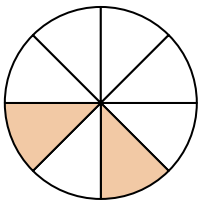

**2)**

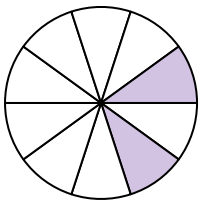

**3)**

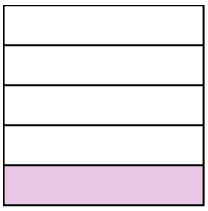

**4)**



**5)**

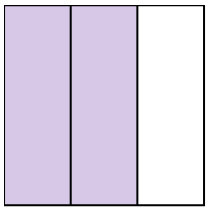

**6)**

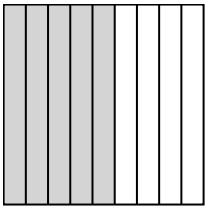

**7)**

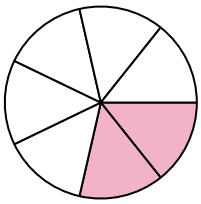

**8)**



**9)**



**10)**

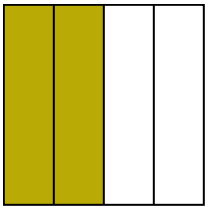

**11)**



**12)**



**13)**

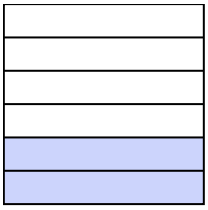

**14)**

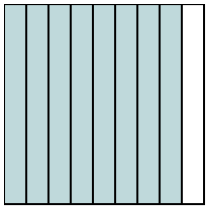

## Réponses

Ex. sept huitièmes

1. deux huitièmes
2. les deux dixièmes
3. un cinquième
4. une moitié
5. les deux tiers
6. cinq neuvièmes
7. deux septièmes
8. un tiers
9. les trois cinquièmes
10. les deux quarts
11. cinq sixièmes
12. huit dixièmes
13. les deux sixièmes
14. huit neuvièmes



| | | | | | | | | | | |
|---|---|---|---|---|---|---|---|---|---|---|
| 1-10 | 93 | 86 | 79 | 71 | 64 | 57 | 50 | 43 | 36 | 29 |
| 11-14 | 21 | 14 | 7 | 0 | | | | | | |

Exprimer des fractions sous forme de mots Nom:

**Écrivez le montant ombré sous forme de mot.**

Ex)

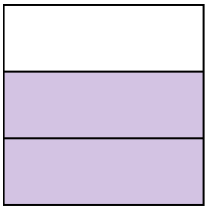

1)

2)



3)



4)



5)

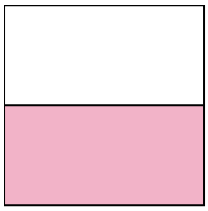

6)

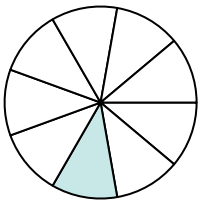

7)

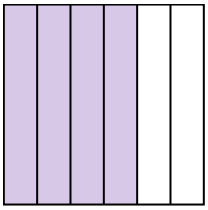

8)



9)

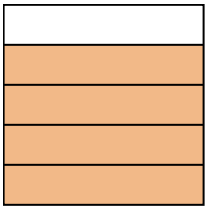

10)

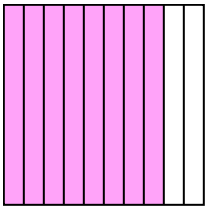

11)

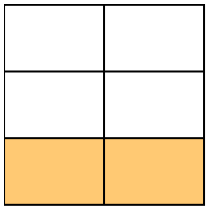

12)

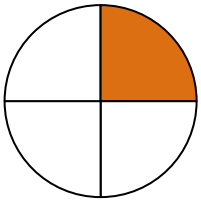

13)

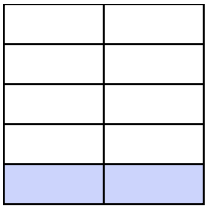

14)

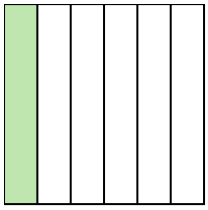

## Réponses

Ex. les deux tiers

1. _____
2. _____
3. _____
4. _____
5. _____
6. _____
7. _____
8. _____
9. _____
10. _____
11. _____
12. _____
13. _____
14. _____



| | | | | | | | | | | |
|---|---|---|---|---|---|---|---|---|---|---|
| 1-10 | 93 | 86 | 79 | 71 | 64 | 57 | 50 | 43 | 36 | 29 |
| 11-14 | 21 | 14 | 7 | 0 | | | | | | |

Exprimer des fractions sous forme de mots Nom: **Clé**

**Écrivez le montant ombré sous forme de mot.**

**Ex)**
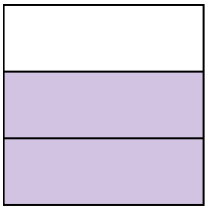

**1)**

**2)**


**3)**


**4)**


**5)**
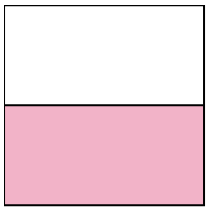

**6)**
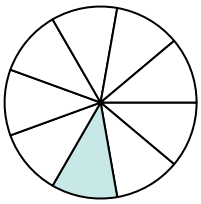

**7)**
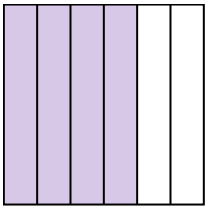

**8)**


**9)**
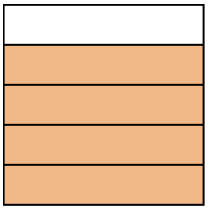

**10)**
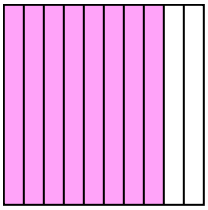

**11)**
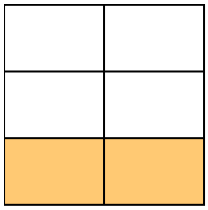

**12)**
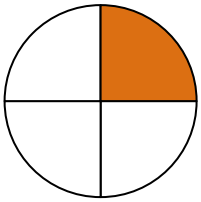

**13)**
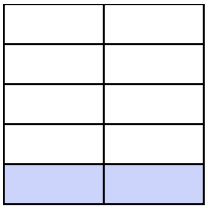

**14)**
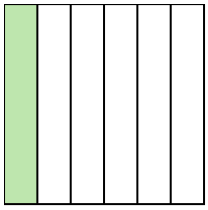

## Réponses

Ex. **les deux tiers**

1. **les deux quarts**
2. **trois-septièmes**
3. **un tiers**
4. **une moitié**
5. **une moitié**
6. **un neuvième**
7. **quatre sixièmes**
8. **sept huitièmes**
9. **quatre cinquièmes**
10. **huit dixièmes**
11. **deux cinquièmes**
12. **un quart**
13. **deux neuvièmes**
14. **un sixième**



| | | | | | | | | | | |
|---|---|---|---|---|---|---|---|---|---|---|
| 1-10 | 93 | 86 | 79 | 71 | 64 | 57 | 50 | 43 | 36 | 29 |
| 11-14 | 21 | 14 | 7 | 0 | | | | | | |

Exprimer des fractions sous forme de mots Nom:

**Écrivez le montant ombré sous forme de mot.**

**Ex)**



**1)**



**2)**

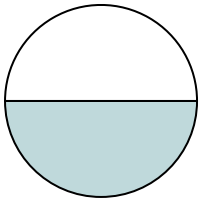

**3)**

**4)**

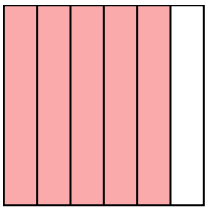

**5)**

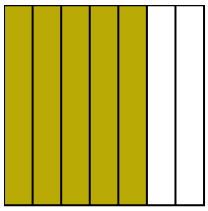

**6)**

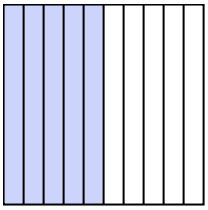

**7)**

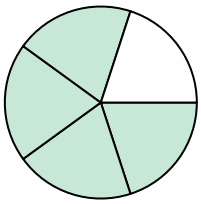

**8)**

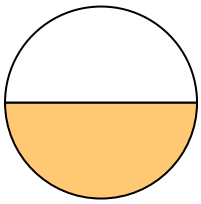

**9)**

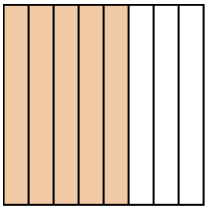

**10)**

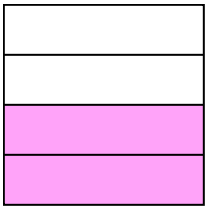

**11)**



**12)**

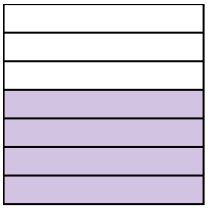

**13)**

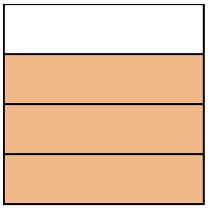

**14)**

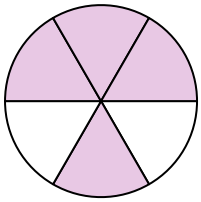

## Réponses

Ex. **un tiers**

1. _____
2. _____
3. _____
4. _____
5. _____
6. _____
7. _____
8. _____
9. _____
10. _____
11. _____
12. _____
13. _____
14. _____



| | | | | | | | | | | |
|---|---|---|---|---|---|---|---|---|---|---|
| 1-10 | 93 | 86 | 79 | 71 | 64 | 57 | 50 | 43 | 36 | 29 |
| 11-14 | 21 | 14 | 7 | 0 | | | | | | |

Exprimer des fractions sous forme de mots Nom: **Clé**

**Écrivez le montant ombré sous forme de mot.**

**Ex)**



**1)**



**2)**

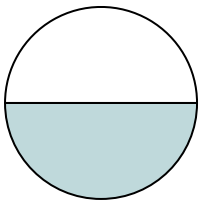

**3)**

**4)**

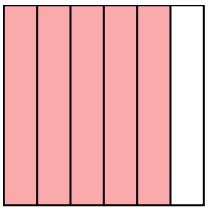

**5)**

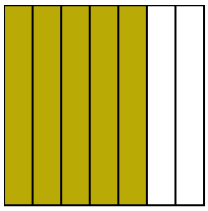

**6)**

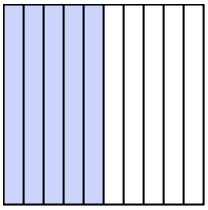

**7)**

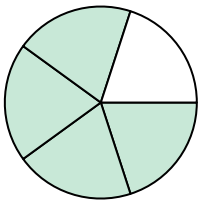

**8)**

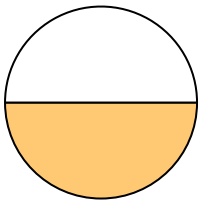

**9)**

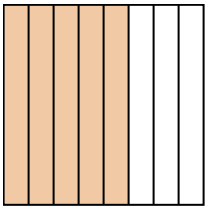

**10)**

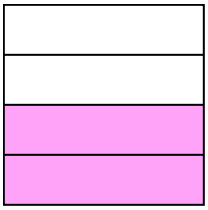

**11)**



**12)**

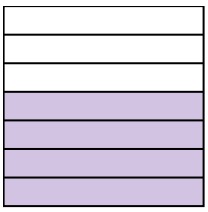

**13)**



**14)**

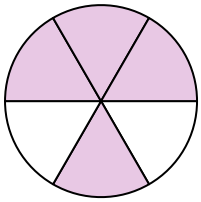

## Réponses

Ex. un tiers

1. les deux tiers
2. une moitié
3. un cinquième
4. cinq sixièmes
5. cinq septièmes
6. cinq dixièmes
7. quatre cinquièmes
8. une moitié
9. cinq huitièmes
10. les deux quarts
11. un huit
12. quatre septièmes
13. trois quarts
14. quatre sixièmes



| | | | | | | | | | | |
|---|---|---|---|---|---|---|---|---|---|---|
| 1-10 | 93 | 86 | 79 | 71 | 64 | 57 | 50 | 43 | 36 | 29 |
| 11-14 | 21 | 14 | 7 | 0 | | | | | | |

Exprimer des fractions sous forme de mots Nom:

**Écrivez le montant ombré sous forme de mot.**

**Ex)**

**1)**

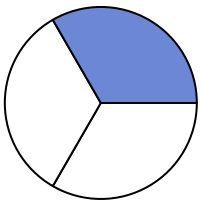

**2)**

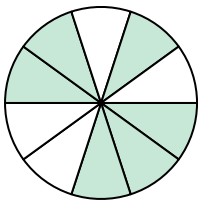

**3)**

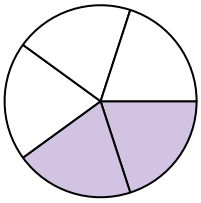

**4)**

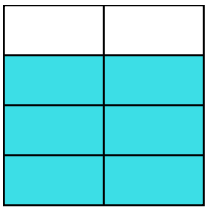

**5)**

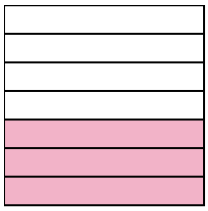

**6)**

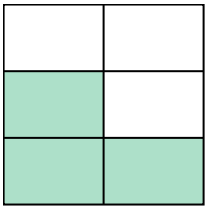

**7)**

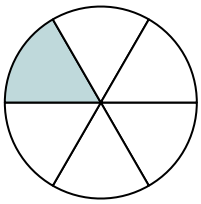

**8)**

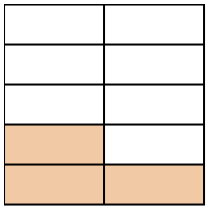

**9)**

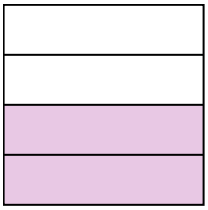

**10)**

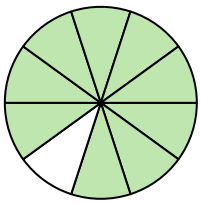

**11)**

**12)**

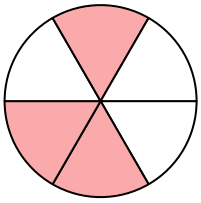

**13)**



**14)**

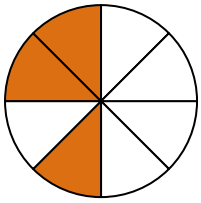

## Réponses

Ex. cinq huitièmes

1. _____
2. _____
3. _____
4. _____
5. _____
6. _____
7. _____
8. _____
9. _____
10. _____
11. _____
12. _____
13. _____
14. _____



| | | | | | | | | | | |
|---|---|---|---|---|---|---|---|---|---|---|
| 1-10 | 93 | 86 | 79 | 71 | 64 | 57 | 50 | 43 | 36 | 29 |
| 11-14 | 21 | 14 | 7 | 0 | | | | | | |

Exprimer des fractions sous forme de mots Nom: **Clé**

**Écrivez le montant ombré sous forme de mot.**

**Ex)**

**1)**

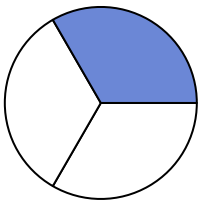

**2)**

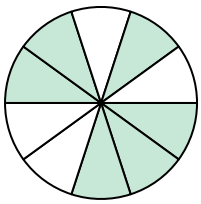

**3)**

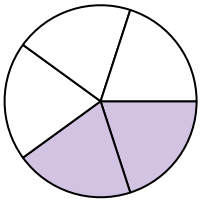

**4)**

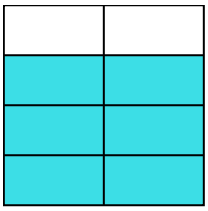

**5)**

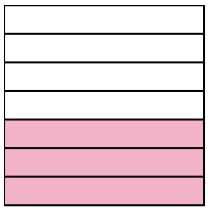

**6)**

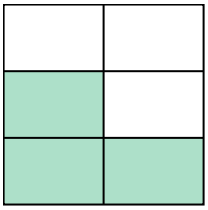

**7)**

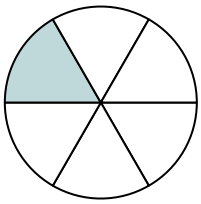

**8)**

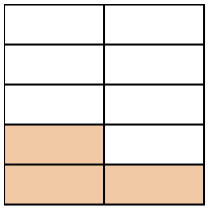

**9)**

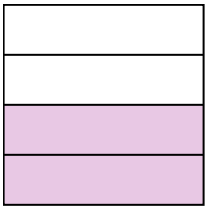

**10)**

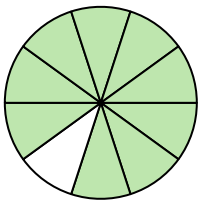

**11)**

**12)**

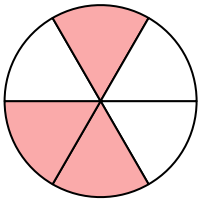

**13)**



**14)**

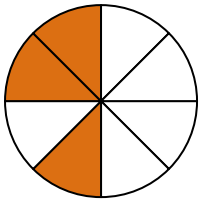

## Réponses

Ex. cinq huitièmes

1. un tiers
2. six dixièmes
3. deux cinquièmes
4. six-septièmes
5. trois-septièmes
6. les trois cinquièmes
7. un sixième
8. trois neuvièmes
9. les deux quarts
10. neuf dixièmes
11. trois quarts
12. trois sixièmes
13. une moitié
14. trois huitièmes



| | | | | | | | | | | |
|---|---|---|---|---|---|---|---|---|---|---|
| 1-10 | 93 | 86 | 79 | 71 | 64 | 57 | 50 | 43 | 36 | 29 |
| 11-14 | 21 | 14 | 7 | 0 | | | | | | |

Exprimer des fractions sous forme de mots Nom:

**Écrivez le montant ombré sous forme de mot.**

Ex) 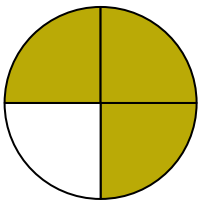

1)

2) 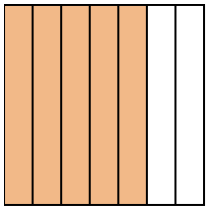

3) 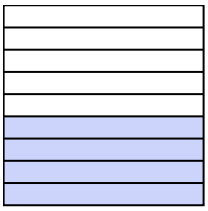

4) 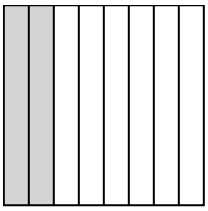

5) 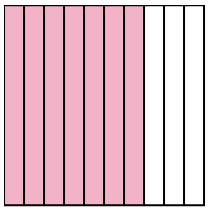

6) 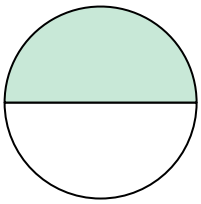

7) 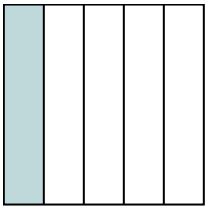

8) 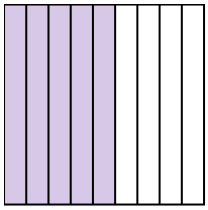

9)

10) 

11) 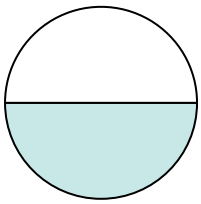

12) 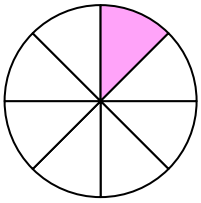

13)

14) 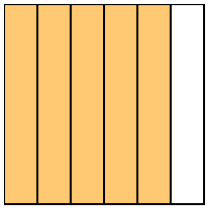

## Réponses

Ex. trois quarts

1. _____
2. _____
3. _____
4. _____
5. _____
6. _____
7. _____
8. _____
9. _____
10. _____
11. _____
12. _____
13. _____
14. _____



| | | | | | | | | | | |
|---|---|---|---|---|---|---|---|---|---|---|
| 1-10 | 93 | 86 | 79 | 71 | 64 | 57 | 50 | 43 | 36 | 29 |
| 11-14 | 21 | 14 | 7 | 0 | | | | | | |

Exprimer des fractions sous forme de mots Nom: **Clé**

**Écrivez le montant ombré sous forme de mot.**

**Ex)**

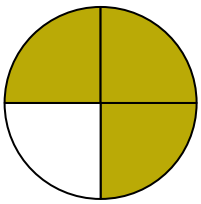

**1)**

**2)**

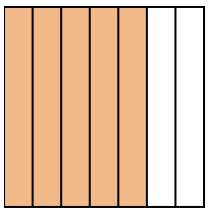

**3)**

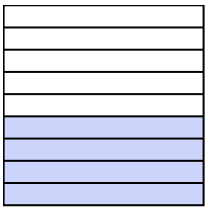

**4)**

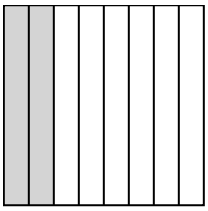

**5)**

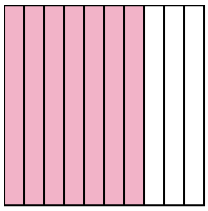

**6)**

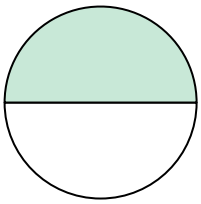

**7)**

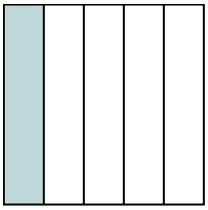

**8)**

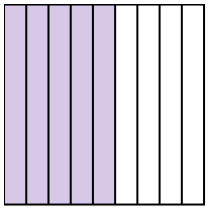

**9)**

**10)**



**11)**

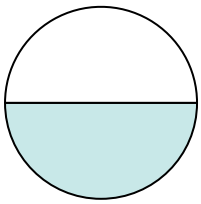

**12)**

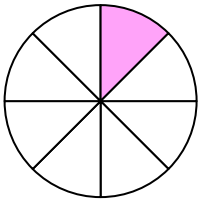

**13)**

**14)**

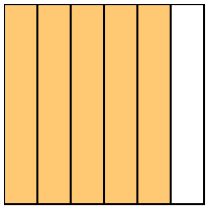

## Réponses

Ex. trois quarts

1. un quart
2. cinq septièmes
3. quatre neuvièmes
4. deux huitièmes
5. sept dixièmes
6. une moitié
7. un cinquième
8. cinq neuvièmes
9. deux cinquièmes
10. un tiers
11. une moitié
12. un huit
13. les deux dixièmes
14. cinq sixièmes



| | | | | | | | | | | |
|---|---|---|---|---|---|---|---|---|---|---|
| 1-10 | 93 | 86 | 79 | 71 | 64 | 57 | 50 | 43 | 36 | 29 |
| 11-14 | 21 | 14 | 7 | 0 | | | | | | |

Exprimer des fractions sous forme de mots Nom:

**Écrivez le montant ombré sous forme de mot.**

**Ex)**

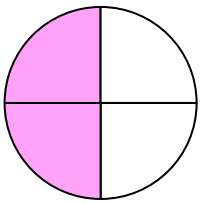

**1)**

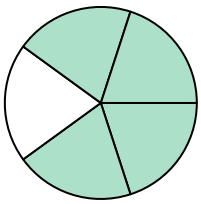

**2)**

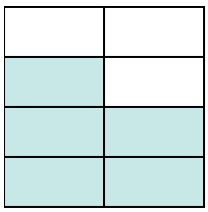

**3)**

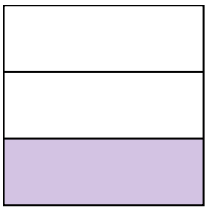

**4)**

**5)**



**6)**



**7)**

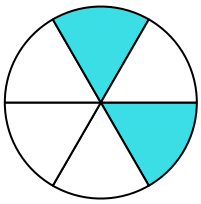

**8)**

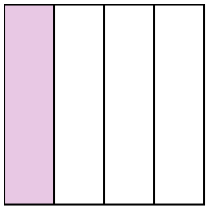

**9)**



**10)**

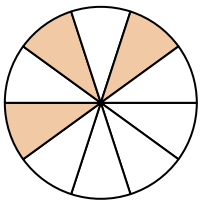

**11)**

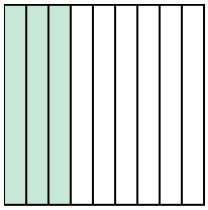

**12)**

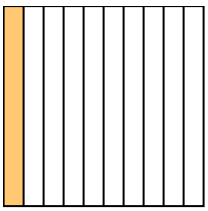

**13)**

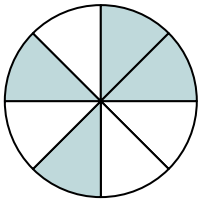

**14)**

## Réponses

Ex. **les deux quarts**

1. _____
2. _____
3. _____
4. _____
5. _____
6. _____
7. _____
8. _____
9. _____
10. _____
11. _____
12. _____
13. _____
14. _____



| | | | | | | | | | | |
|---|---|---|---|---|---|---|---|---|---|---|
| 1-10 | 93 | 86 | 79 | 71 | 64 | 57 | 50 | 43 | 36 | 29 |
| 11-14 | 21 | 14 | 7 | 0 | | | | | | |

Exprimer des fractions sous forme de mots Nom: **Clé**

**Écrivez le montant ombré sous forme de mot.**

**Ex)**

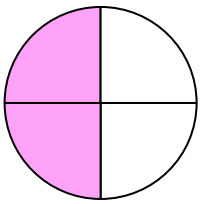

**1)**

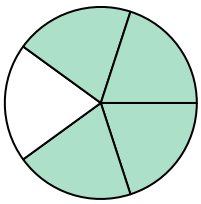

**2)**

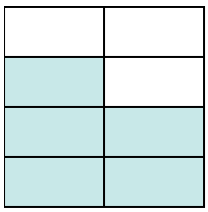

**3)**

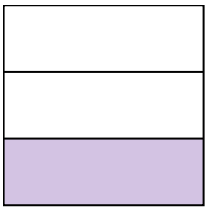

**4)**

**5)**



**6)**



**7)**

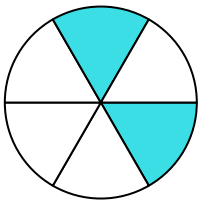

**8)**

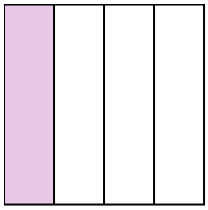

**9)**



**10)**

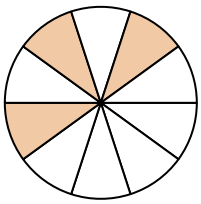

**11)**

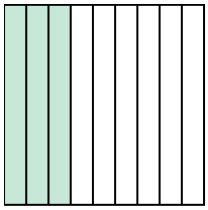

**12)**

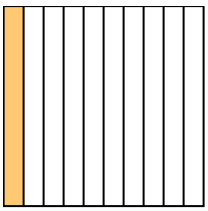

**13)**

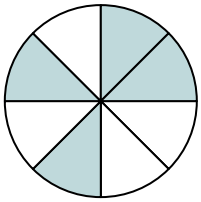

**14)**

## Réponses

Ex. **les deux quarts**

1. **quatre cinquièmes**
2. **cinq septièmes**
3. **un tiers**
4. **trois neuvièmes**
5. **les deux tiers**
6. **une moitié**
7. **les deux sixièmes**
8. **un quart**
9. **une moitié**
10. **les trois dixièmes**
11. **trois neuvièmes**
12. **un dixième**
13. **quatre huitièmes**
14. **cinq huitièmes**



| | | | | | | | | | | |
|---|---|---|---|---|---|---|---|---|---|---|
| 1-10 | 93 | 86 | 79 | 71 | 64 | 57 | 50 | 43 | 36 | 29 |
| 11-14 | 21 | 14 | 7 | 0 | | | | | | |

Exprimer des fractions sous forme de mots Nom:

**Écrivez le montant ombré sous forme de mot.**

**Ex)**



**1)**



**2)**



**3)**

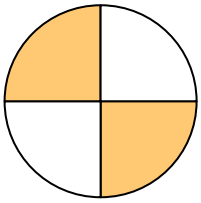

**4)**

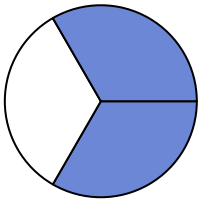

**5)**

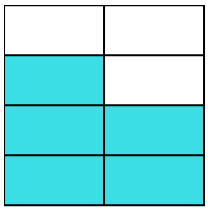

**6)**

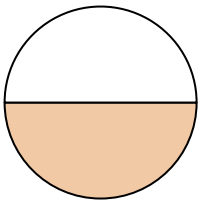

**7)**



**8)**

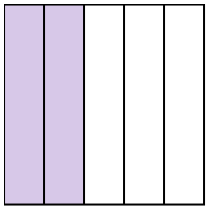

**9)**



**10)**



**11)**

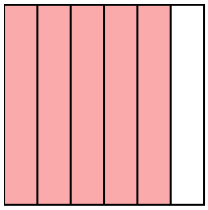

**12)**



**13)**

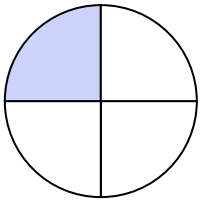

**14)**

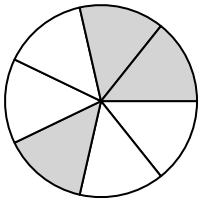

## Réponses

Ex. **une moitié**

1. _____
2. _____
3. _____
4. _____
5. _____
6. _____
7. _____
8. _____
9. _____
10. _____
11. _____
12. _____
13. _____
14. _____



| | | | | | | | | | | |
|---|---|---|---|---|---|---|---|---|---|---|
| 1-10 | 93 | 86 | 79 | 71 | 64 | 57 | 50 | 43 | 36 | 29 |
| 11-14 | 21 | 14 | 7 | 0 | | | | | | |

Exprimer des fractions sous forme de mots Nom: **Clé**

**Écrivez le montant ombré sous forme de mot.**

**Ex)**



**1)**



**2)**



**3)**

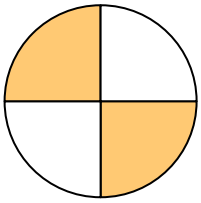

**4)**

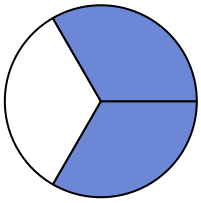

**5)**

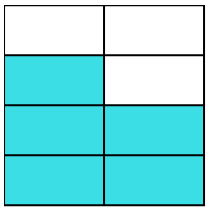

**6)**

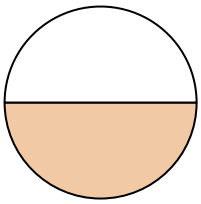

**7)**



**8)**

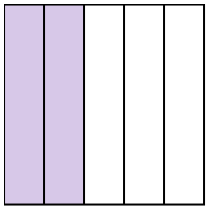

**9)**



**10)**



**11)**

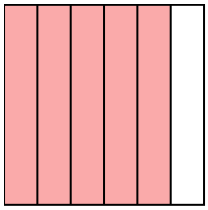

**12)**



**13)**

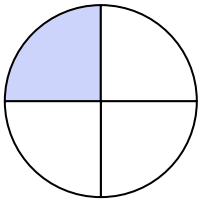

**14)**

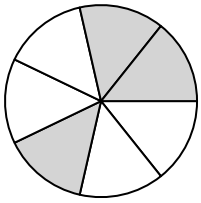

## Réponses

Ex. **une moitié**

1. **deux cinquièmes**
2. **cinq dixièmes**
3. **les deux quarts**
4. **les deux tiers**
5. **cinq septièmes**
6. **une moitié**
7. **quatre huitièmes**
8. **deux cinquièmes**
9. **les deux tiers**
10. **un neuvième**
11. **cinq sixièmes**
12. **trois sixièmes**
13. **un quart**
14. **trois-septièmes**



| | | | | | | | | | | |
|---|---|---|---|---|---|---|---|---|---|---|
| 1-10 | 93 | 86 | 79 | 71 | 64 | 57 | 50 | 43 | 36 | 29 |
| 11-14 | 21 | 14 | 7 | 0 | | | | | | |

Exprimer des fractions sous forme de mots Nom:

**Écrivez le montant ombré sous forme de mot.**

**Ex)**

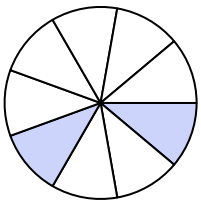

**1)**



**2)**



**3)**

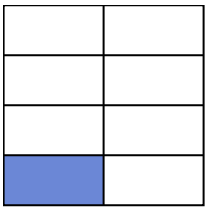

**4)**

**5)**

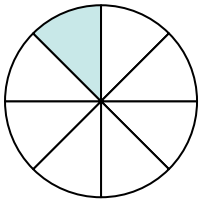

**6)**

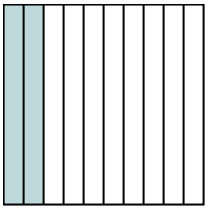

**7)**

**8)**

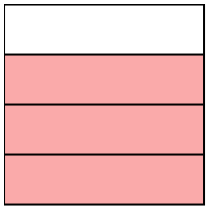

**9)**

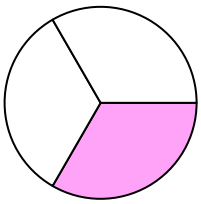

**10)**

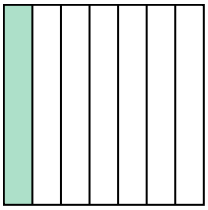

**11)**

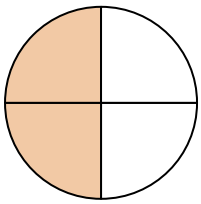

**12)**

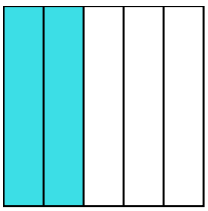

**13)**

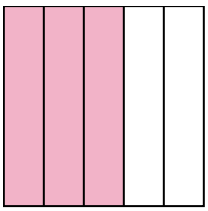

**14)**

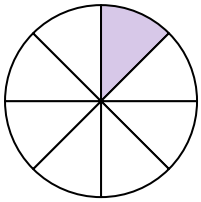

## Réponses

Ex. deux neuvièmes

1. _____
2. _____
3. _____
4. _____
5. _____
6. _____
7. _____
8. _____
9. _____
10. _____
11. _____
12. _____
13. _____
14. _____



| | | | | | | | | | | |
|---|---|---|---|---|---|---|---|---|---|---|
| 1-10 | 93 | 86 | 79 | 71 | 64 | 57 | 50 | 43 | 36 | 29 |
| 11-14 | 21 | 14 | 7 | 0 | | | | | | |

Exprimer des fractions sous forme de mots Nom: **Clé**

**Écrivez le montant ombré sous forme de mot.**

**Ex)**

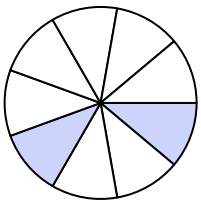

**1)**



**2)**



**3)**

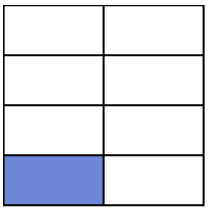

**4)**

**5)**

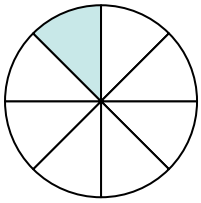

**6)**

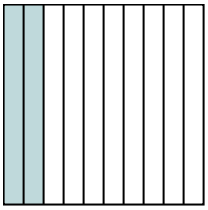

**7)**

**8)**

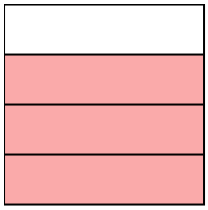

**9)**

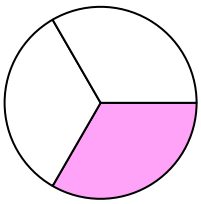

**10)**

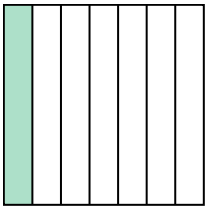

**11)**

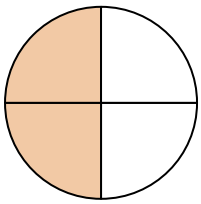

**12)**

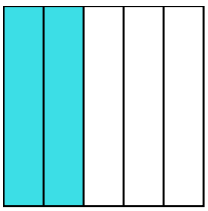

**13)**

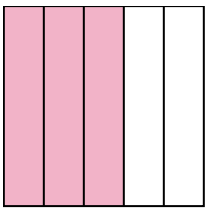

**14)**

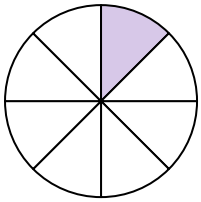

## Réponses

Ex. deux neuvièmes

1. neuf dixièmes
2. une moitié
3. Un septième
4. sept neuvièmes
5. un huit
6. les deux dixièmes
7. quatre sixièmes
8. trois quarts
9. un tiers
10. Un septième
11. les deux quarts
12. deux cinquièmes
13. les trois cinquièmes
14. un huit



| | | | | | | | | | | |
|---|---|---|---|---|---|---|---|---|---|---|
| 1-10 | 93 | 86 | 79 | 71 | 64 | 57 | 50 | 43 | 36 | 29 |
| 11-14 | 21 | 14 | 7 | 0 | | | | | | |