Trouver la Fraction Équivalente - Visuel

Nom:

Déterminez quelle lettre représente le mieux chaque fraction.

1) 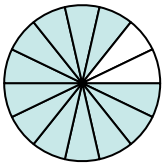

$\frac{12}{14}$

2) 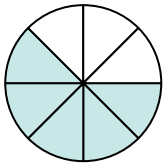

$\frac{5}{8}$

3) 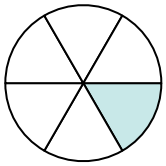

$\frac{1}{6}$

4) 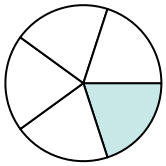

$\frac{1}{5}$

5) 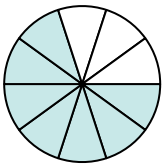

$\frac{7}{10}$

6) 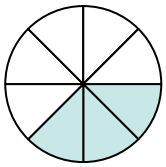

$\frac{3}{8}$

7) 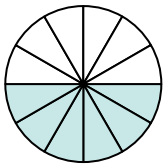

$\frac{6}{12}$

8) 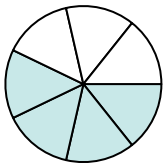

$\frac{4}{7}$

9) 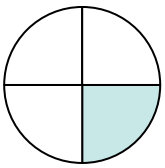

$\frac{1}{4}$

10) 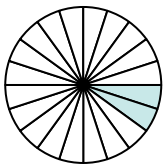

$\frac{2}{20}$

11) 

$\frac{10}{20}$

12) 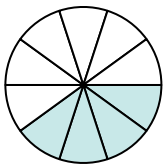

$\frac{4}{10}$

A. 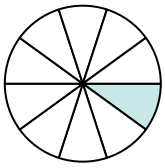

$\frac{1}{10}$

B. 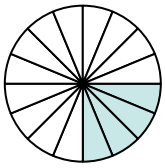

$\frac{4}{16}$

C. 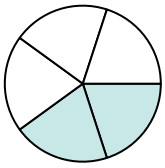

$\frac{2}{5}$

D. 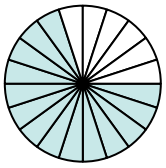

$\frac{14}{20}$

E. 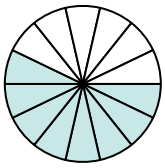

$\frac{8}{14}$

F. 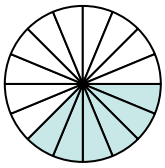

$\frac{6}{16}$

G. 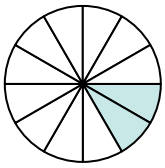

$\frac{2}{12}$

H. 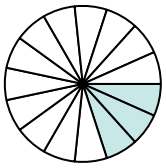

$\frac{3}{15}$

I. 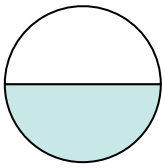

$\frac{1}{2}$

J. 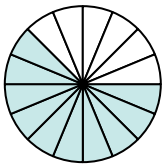

$\frac{10}{16}$

K. 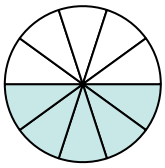

$\frac{5}{10}$

L. 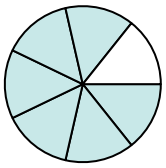

$\frac{6}{7}$

Réponses

1. _____
2. _____
3. _____
4. _____
5. _____
6. _____
7. _____
8. _____
9. _____
10. _____
11. _____
12. _____

1-10	92	83	75	67	58	50	42	33	25	17
11-12	8	0								

Trouver la Fraction Équivalente - Visuel

Nom: **Clé**

Déterminez quelle lettre représente le mieux chaque fraction.

1)

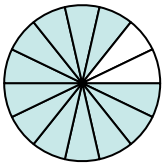

$\frac{12}{14}$

2)

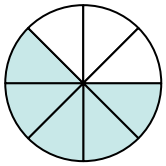

$\frac{5}{8}$

3)

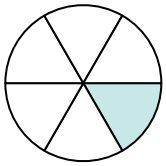

$\frac{1}{6}$

4)

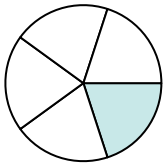

$\frac{1}{5}$

5)

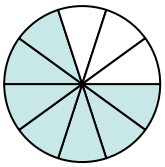

$\frac{7}{10}$

6)

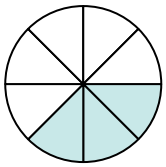

$\frac{3}{8}$

7)

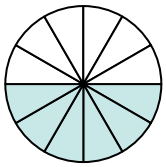

$\frac{6}{12}$

8)

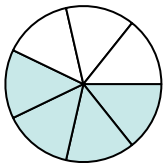

$\frac{4}{7}$

9)

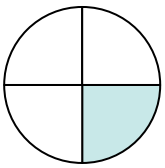

$\frac{1}{4}$

10)

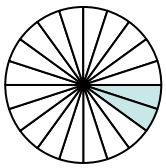

$\frac{2}{20}$

11)



$\frac{10}{20}$

12)

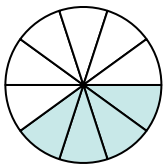

$\frac{4}{10}$

A.

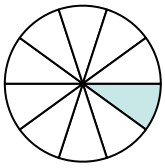

$\frac{1}{10}$

B.

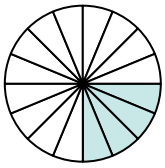

$\frac{4}{16}$

C.

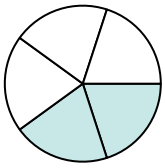

$\frac{2}{5}$

D.

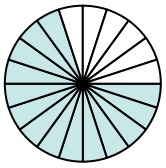

$\frac{14}{20}$

E.

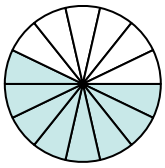

$\frac{8}{14}$

F.

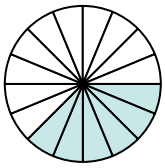

$\frac{6}{16}$

G.

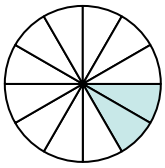

$\frac{2}{12}$

H.

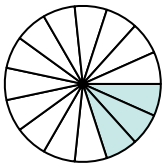

$\frac{3}{15}$

I.

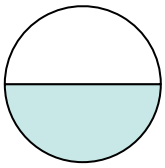

$\frac{1}{2}$

J.

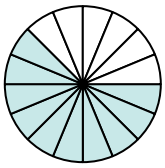

$\frac{10}{16}$

K.

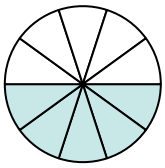

$\frac{5}{10}$

L.

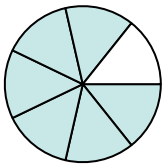

$\frac{6}{7}$

Réponses

1. L
2. J
3. G
4. H
5. D
6. F
7. I
8. E
9. B
10. A
11. K
12. C

1-10	92	83	75	67	58	50	42	33	25	17
11-12	8	0								