Résoudre chaque problème.

1) Marquer l'emplacement du $^{8}/_{5}$



2) Marquer l'emplacement du $^{14}/_{7}$

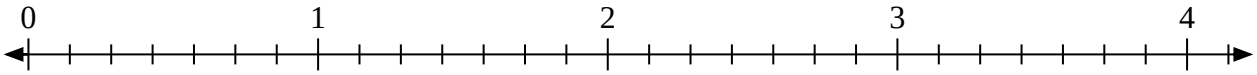

3) Marquer l'emplacement du $^{10}/_{6}$

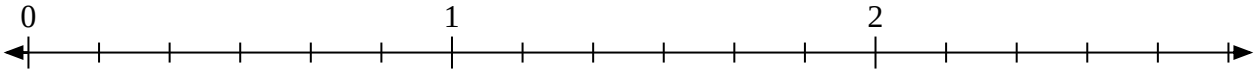

4) Marquer l'emplacement du $^{7}/_{3}$

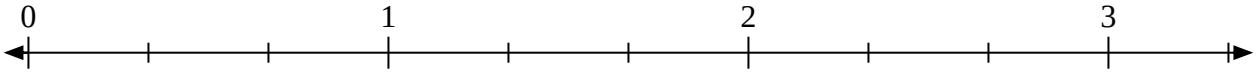

5) Marquer l'emplacement du $^{3}/_{2}$



6) Marquer l'emplacement du $^{11}/_{5}$

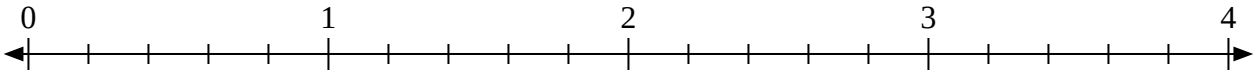

7) Marquer l'emplacement du $^{15}/_{9}$

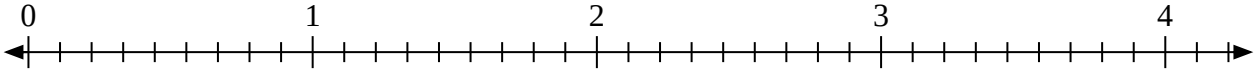

8) Marquer l'emplacement du $^{21}/_{9}$

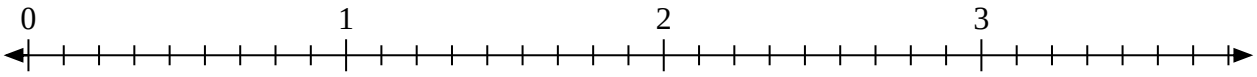

9) Marquer l'emplacement du $^{8}/_{7}$

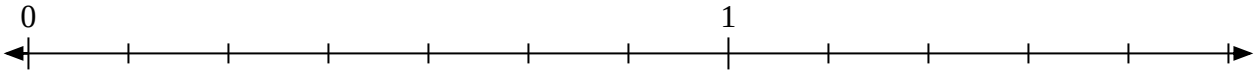

10) Marquer l'emplacement du $^{6}/_{2}$



1-10	90	80	70	60	50	40	30	20	10	0

Identifier les fractions et les décimales sur une roue numérique Nom: **Clé**

Résoudre chaque problème.

1) Marquer l'emplacement du $^{8}/_{5}$

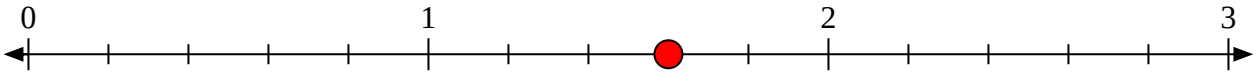

2) Marquer l'emplacement du $^{14}/_{7}$

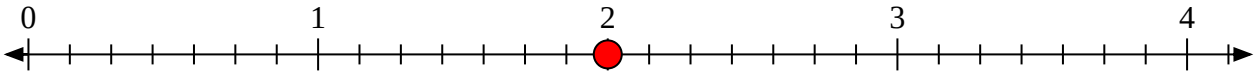

3) Marquer l'emplacement du $^{10}/_{6}$

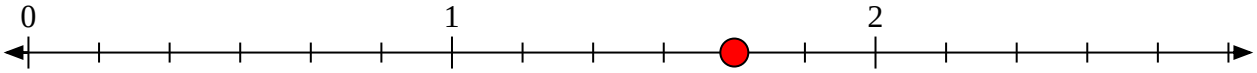

4) Marquer l'emplacement du $^{7}/_{3}$

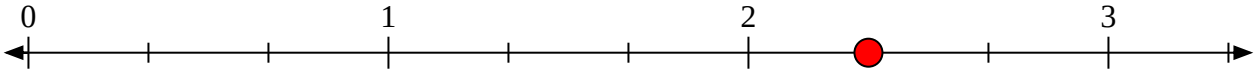

5) Marquer l'emplacement du $^{3}/_{2}$



6) Marquer l'emplacement du $^{11}/_{5}$

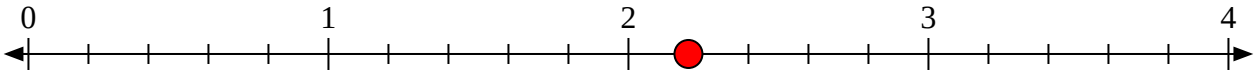

7) Marquer l'emplacement du $^{15}/_{9}$

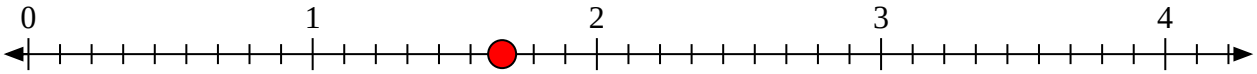

8) Marquer l'emplacement du $^{21}/_{9}$

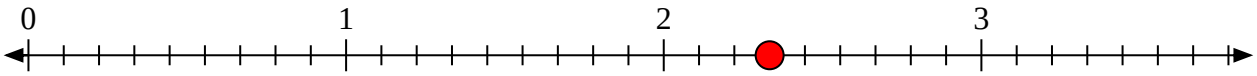

9) Marquer l'emplacement du $^{8}/_{7}$

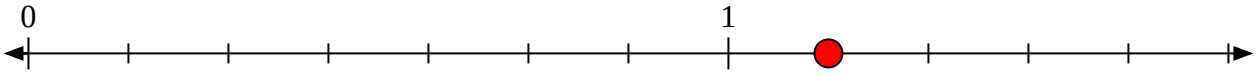

10) Marquer l'emplacement du $^{6}/_{2}$



1-10	90	80	70	60	50	40	30	20	10	0