Résoudre chaque problème.

1) Marquer l'emplacement du $^{3}/_{2}$



2) Marquer l'emplacement du $^{26}/_{9}$

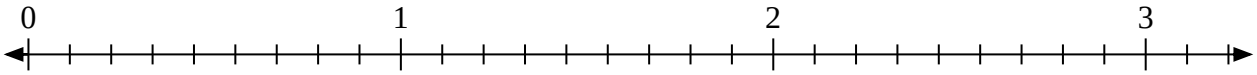

3) Marquer l'emplacement du $^{6}/_{3}$

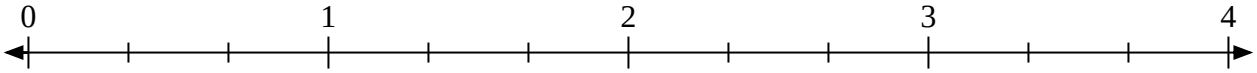

4) Marquer l'emplacement du $^{14}/_{7}$

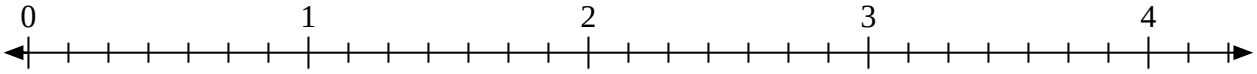

5) Marquer l'emplacement du $^{5}/_{2}$



6) Marquer l'emplacement du $^{22}/_{8}$

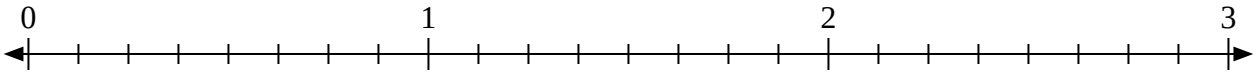

7) Marquer l'emplacement du $^{12}/_{9}$



8) Marquer l'emplacement du $^{11}/_{4}$

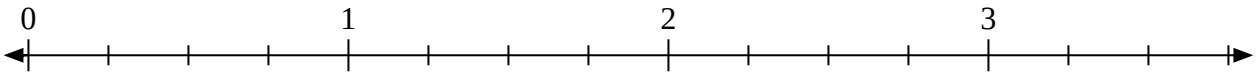

9) Marquer l'emplacement du $^{8}/_{7}$

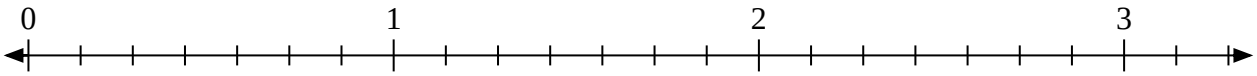

10) Marquer l'emplacement du $^{11}/_{5}$

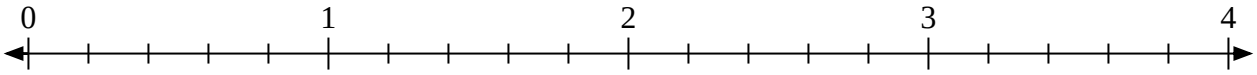

1-10	90	80	70	60	50	40	30	20	10	0

Identifier les fractions et les décimales sur une roue numérique Nom: **Clé**

Résoudre chaque problème.

1) Marquer l'emplacement du $^{3}/_{2}$



2) Marquer l'emplacement du $^{26}/_{9}$

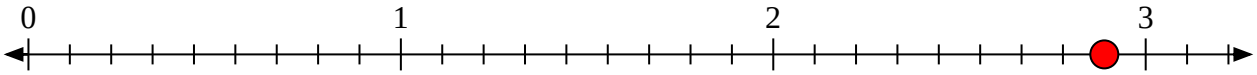

3) Marquer l'emplacement du $^{6}/_{3}$

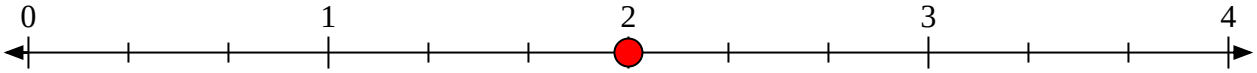

4) Marquer l'emplacement du $^{14}/_{7}$

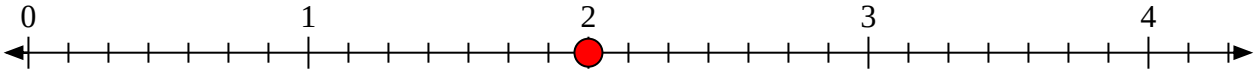

5) Marquer l'emplacement du $^{5}/_{2}$



6) Marquer l'emplacement du $^{22}/_{8}$

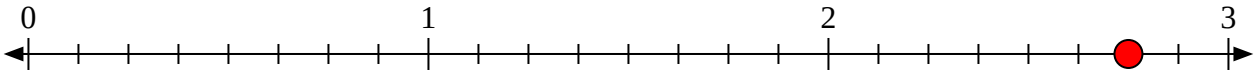

7) Marquer l'emplacement du $^{12}/_{9}$



8) Marquer l'emplacement du $^{11}/_{4}$

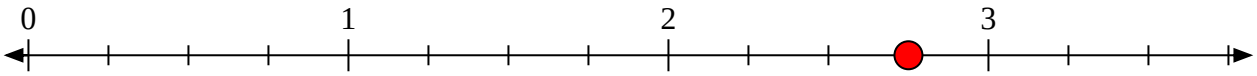

9) Marquer l'emplacement du $^{8}/_{7}$

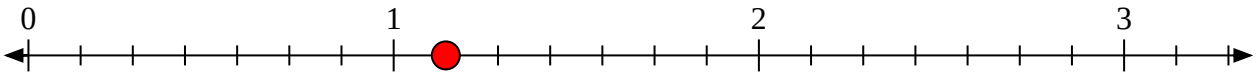

10) Marquer l'emplacement du $^{11}/_{5}$

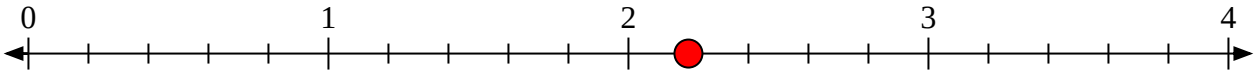

1-10	90	80	70	60	50	40	30	20	10	0