Identifier les fractions et les décimales sur une roue numérique Nom:

Résoudre chaque problème.

1) Marquer l'emplacement du $^{5}/_{3}$



2) Marquer l'emplacement du $^{16}/_{7}$

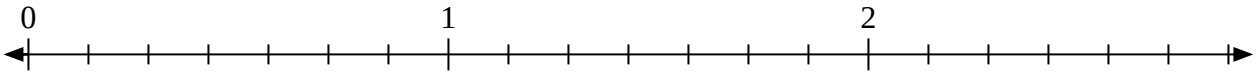

3) Marquer l'emplacement du $^{13}/_{7}$

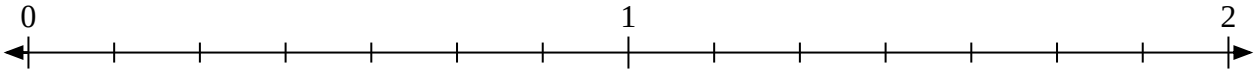

4) Marquer l'emplacement du $^{8}/_{7}$

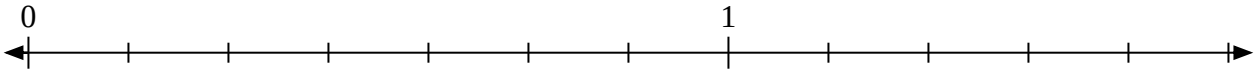

5) Marquer l'emplacement du $^{10}/_{8}$



6) Marquer l'emplacement du $^{10}/_{4}$

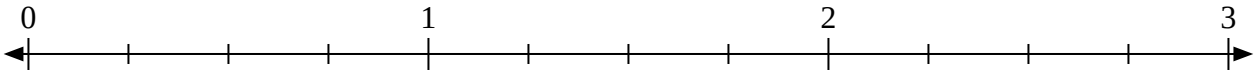

7) Marquer l'emplacement du $^{3}/_{2}$

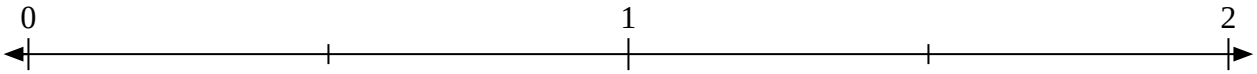

8) Marquer l'emplacement du $^{14}/_{7}$

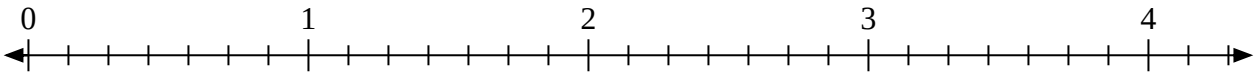

9) Marquer l'emplacement du $^{6}/_{5}$

10) Marquer l'emplacement du $^{11}/_{4}$

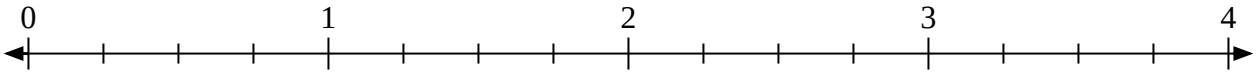

1-10	90	80	70	60	50	40	30	20	10	0

Identifier les fractions et les décimales sur une roue numérique Nom: **Clé**

Résoudre chaque problème.

1) Marquer l'emplacement du $^{5}/_{3}$



2) Marquer l'emplacement du $^{16}/_{7}$

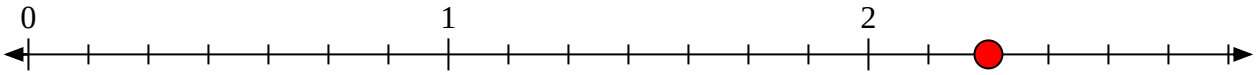

3) Marquer l'emplacement du $^{13}/_{7}$

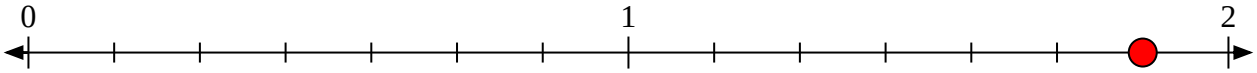

4) Marquer l'emplacement du $^{8}/_{7}$

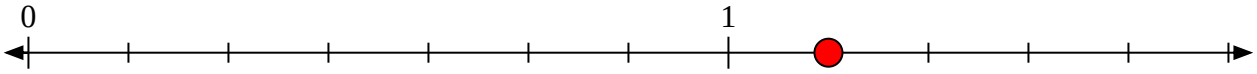

5) Marquer l'emplacement du $^{10}/_{8}$



6) Marquer l'emplacement du $^{10}/_{4}$

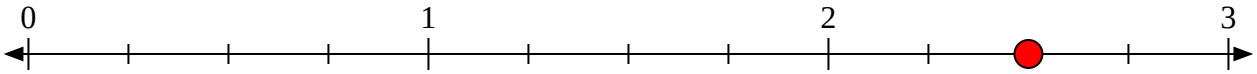

7) Marquer l'emplacement du $^{3}/_{2}$

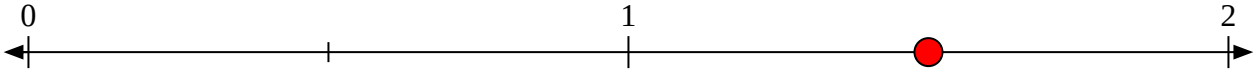

8) Marquer l'emplacement du $^{14}/_{7}$

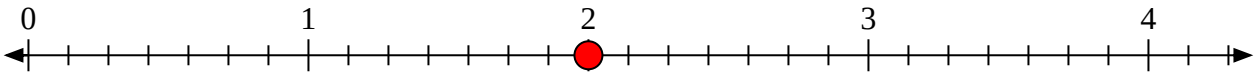

9) Marquer l'emplacement du $^{6}/_{5}$

10) Marquer l'emplacement du $^{11}/_{4}$

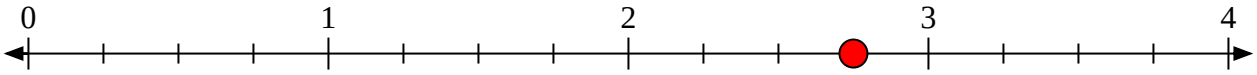

1-10	90	80	70	60	50	40	30	20	10	0

Résoudre chaque problème.

1) Marquer l'emplacement du $^{14}/_{7}$

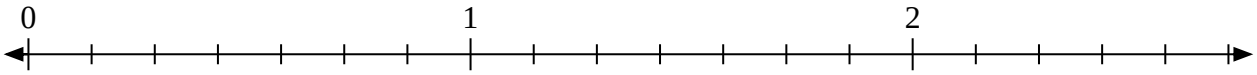

2) Marquer l'emplacement du $^{5}/_{3}$



3) Marquer l'emplacement du $^{12}/_{6}$

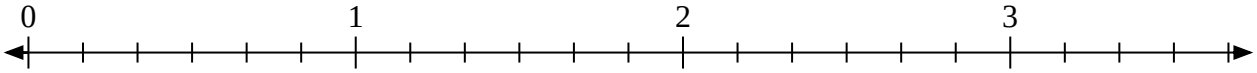

4) Marquer l'emplacement du $^{17}/_{8}$

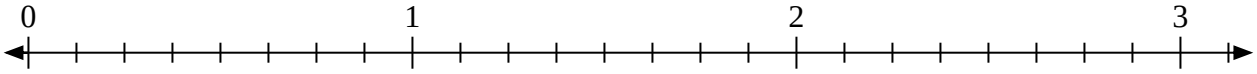

5) Marquer l'emplacement du $^{13}/_{8}$

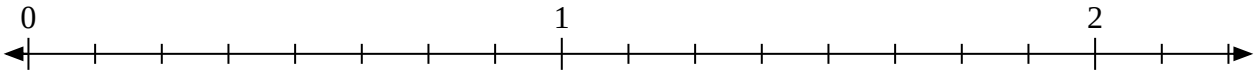

6) Marquer l'emplacement du $^{9}/_{4}$

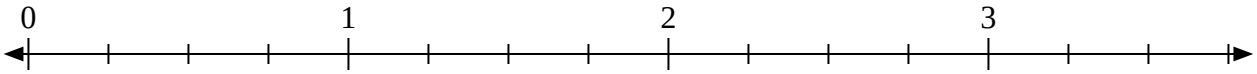

7) Marquer l'emplacement du $^{18}/_{7}$

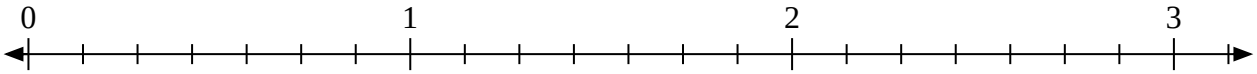

8) Marquer l'emplacement du $^{6}/_{3}$



9) Marquer l'emplacement du $^{3}/_{2}$

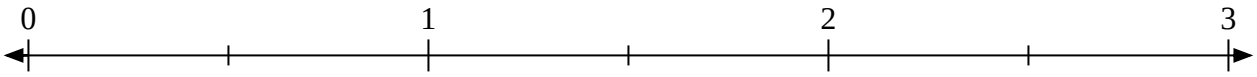

10) Marquer l'emplacement du $^{10}/_{8}$

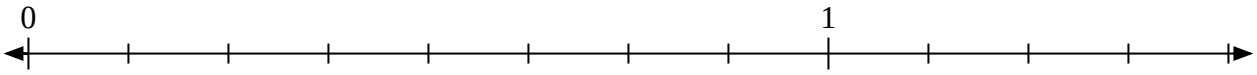

1-10	90	80	70	60	50	40	30	20	10	0

Identifier les fractions et les décimales sur une roue numérique Nom: **Clé**

Résoudre chaque problème.

1) Marquer l'emplacement du $^{14}/_{7}$

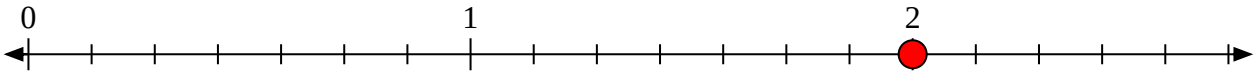

2) Marquer l'emplacement du $^{5}/_{3}$



3) Marquer l'emplacement du $^{12}/_{6}$

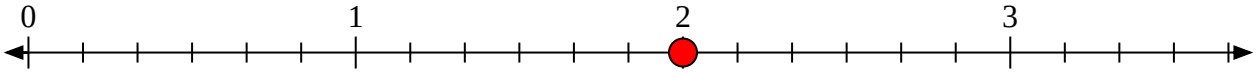

4) Marquer l'emplacement du $^{17}/_{8}$

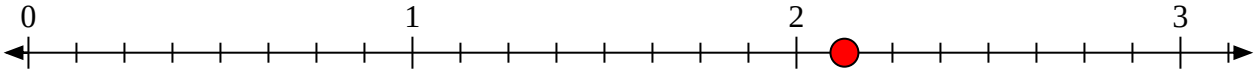

5) Marquer l'emplacement du $^{13}/_{8}$

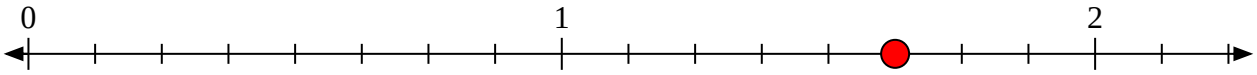

6) Marquer l'emplacement du $^{9}/_{4}$

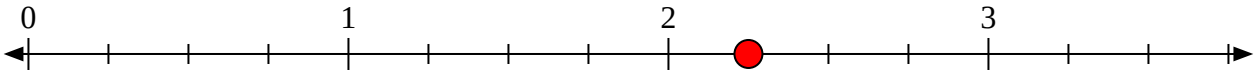

7) Marquer l'emplacement du $^{18}/_{7}$

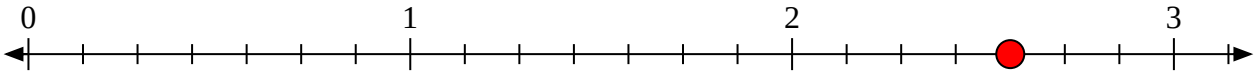

8) Marquer l'emplacement du $^{6}/_{3}$



9) Marquer l'emplacement du $^{3}/_{2}$

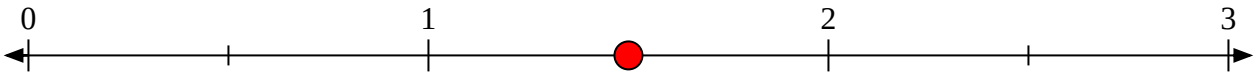

10) Marquer l'emplacement du $^{10}/_{8}$

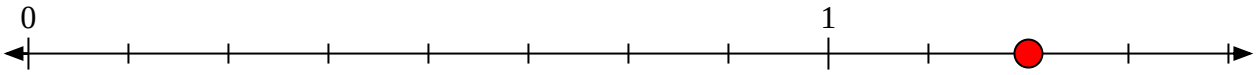

1-10	90	80	70	60	50	40	30	20	10	0

Résoudre chaque problème.

1) Marquer l'emplacement du $^{6}/_{3}$



2) Marquer l'emplacement du $^{5}/_{4}$



3) Marquer l'emplacement du $^{3}/_{2}$

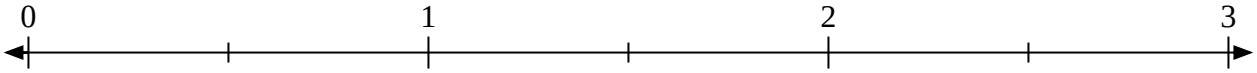

4) Marquer l'emplacement du $^{12}/_{6}$

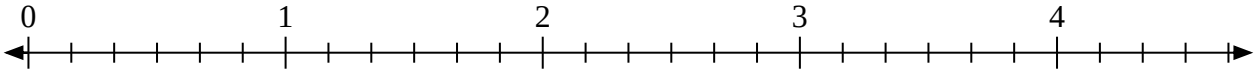

5) Marquer l'emplacement du $^{20}/_{9}$

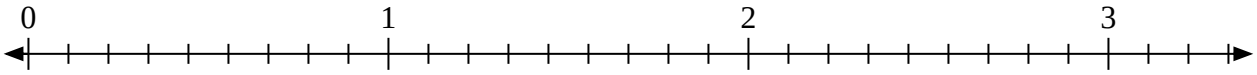

6) Marquer l'emplacement du $^{4}/_{2}$



7) Marquer l'emplacement du $^{5}/_{3}$



8) Marquer l'emplacement du $^{11}/_{6}$

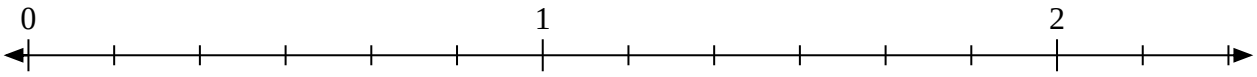

9) Marquer l'emplacement du $^{9}/_{4}$

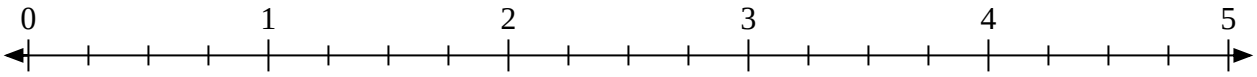

10) Marquer l'emplacement du $^{14}/_{9}$

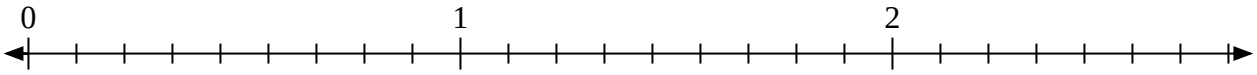

1-10	90	80	70	60	50	40	30	20	10	0

Identifier les fractions et les décimales sur une roue numérique Nom: **Clé**

Résoudre chaque problème.

1) Marquer l'emplacement du $^{6}/_{3}$



2) Marquer l'emplacement du $^{5}/_{4}$



3) Marquer l'emplacement du $^{3}/_{2}$

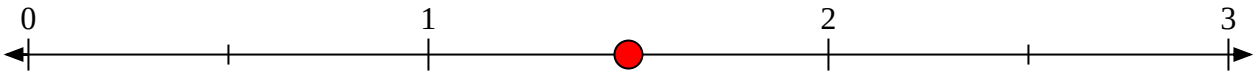

4) Marquer l'emplacement du $^{12}/_{6}$

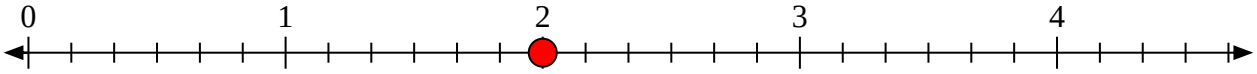

5) Marquer l'emplacement du $^{20}/_{9}$

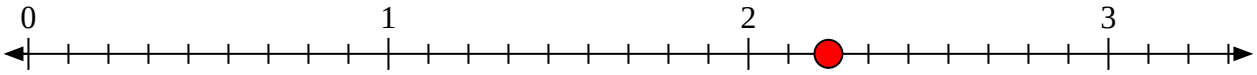

6) Marquer l'emplacement du $^{4}/_{2}$



7) Marquer l'emplacement du $^{5}/_{3}$



8) Marquer l'emplacement du $^{11}/_{6}$

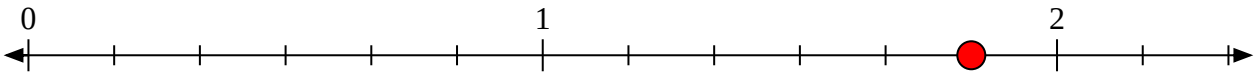

9) Marquer l'emplacement du $^{9}/_{4}$

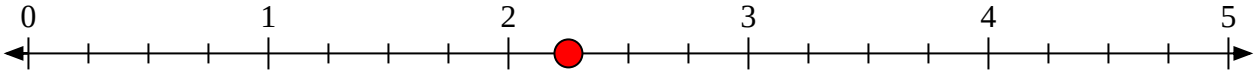

10) Marquer l'emplacement du $^{14}/_{9}$

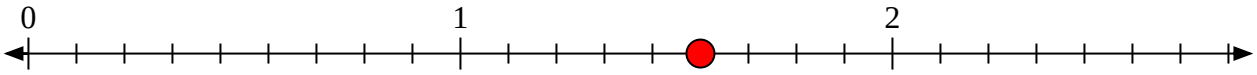

1-10	90	80	70	60	50	40	30	20	10	0

Résoudre chaque problème.

1) Marquer l'emplacement du $^{4}/_{3}$

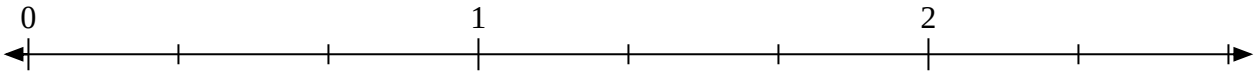

2) Marquer l'emplacement du $^{15}/_{6}$

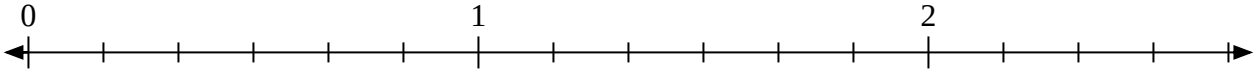

3) Marquer l'emplacement du $^{11}/_{8}$

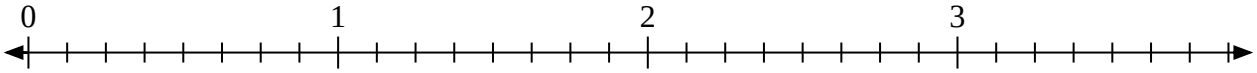

4) Marquer l'emplacement du $^{10}/_{4}$



5) Marquer l'emplacement du $^{21}/_{8}$

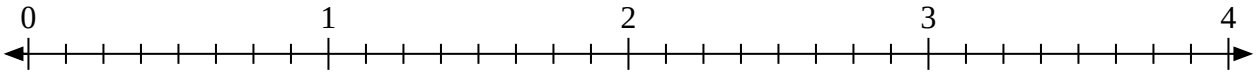

6) Marquer l'emplacement du $^{4}/_{2}$

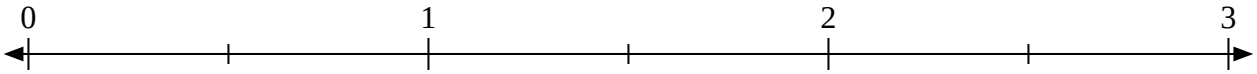

7) Marquer l'emplacement du $^{3}/_{2}$



8) Marquer l'emplacement du $^{14}/_{9}$

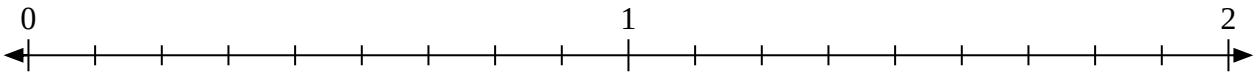

9) Marquer l'emplacement du $^{20}/_{9}$

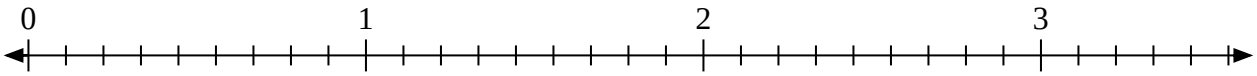

10) Marquer l'emplacement du $^{9}/_{6}$

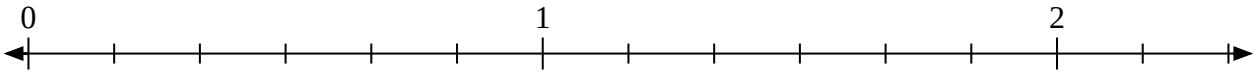

1-10	90	80	70	60	50	40	30	20	10	0

Identifier les fractions et les décimales sur une roue numérique Nom: **Clé**

Résoudre chaque problème.

1) Marquer l'emplacement du $^{4}/_{3}$

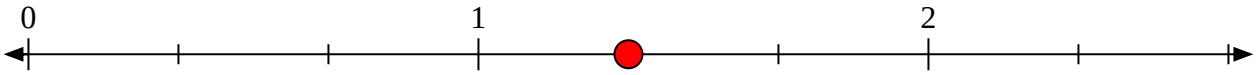

2) Marquer l'emplacement du $^{15}/_{6}$

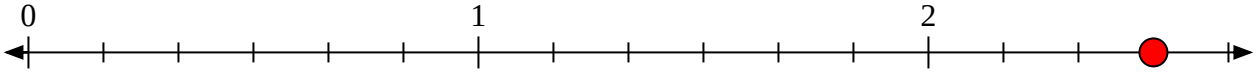

3) Marquer l'emplacement du $^{11}/_{8}$

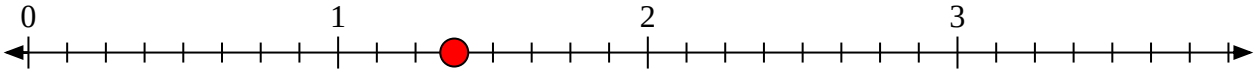

4) Marquer l'emplacement du $^{10}/_{4}$



5) Marquer l'emplacement du $^{21}/_{8}$

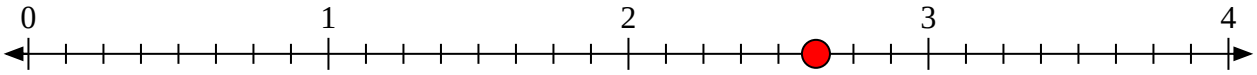

6) Marquer l'emplacement du $^{4}/_{2}$

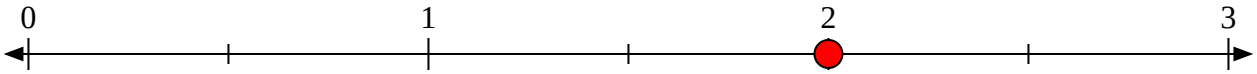

7) Marquer l'emplacement du $^{3}/_{2}$



8) Marquer l'emplacement du $^{14}/_{9}$

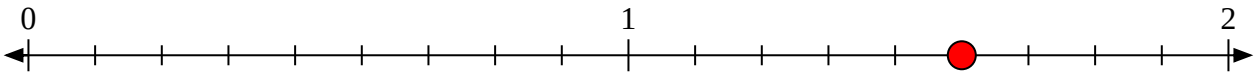

9) Marquer l'emplacement du $^{20}/_{9}$

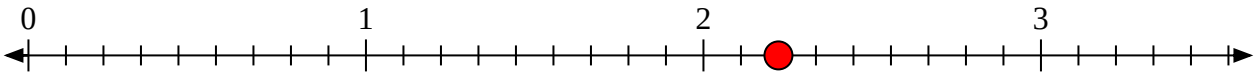

10) Marquer l'emplacement du $^{9}/_{6}$

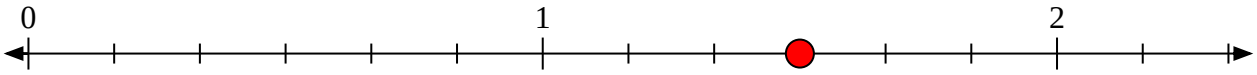

1-10	90	80	70	60	50	40	30	20	10	0

Résoudre chaque problème.

1) Marquer l'emplacement du $^{8}/_{5}$



2) Marquer l'emplacement du $^{14}/_{7}$

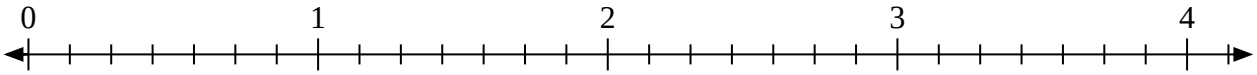

3) Marquer l'emplacement du $^{10}/_{6}$

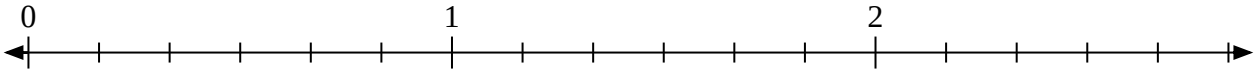

4) Marquer l'emplacement du $^{7}/_{3}$

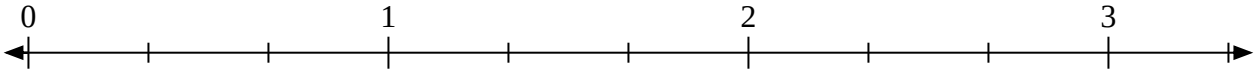

5) Marquer l'emplacement du $^{3}/_{2}$



6) Marquer l'emplacement du $^{11}/_{5}$

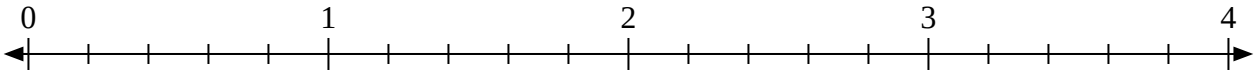

7) Marquer l'emplacement du $^{15}/_{9}$

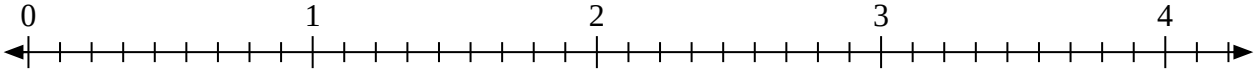

8) Marquer l'emplacement du $^{21}/_{9}$

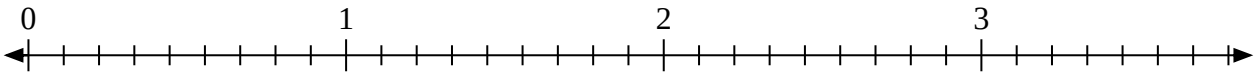

9) Marquer l'emplacement du $^{8}/_{7}$

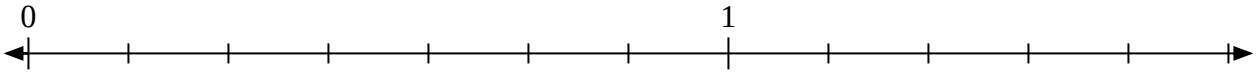

10) Marquer l'emplacement du $^{6}/_{2}$



1-10	90	80	70	60	50	40	30	20	10	0

Identifier les fractions et les décimales sur une roue numérique Nom: **Clé**

Résoudre chaque problème.

1) Marquer l'emplacement du $^{8}/_{5}$

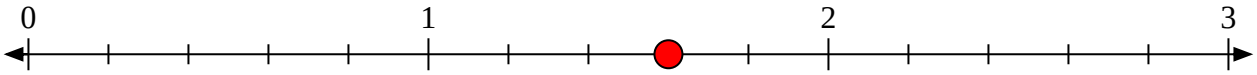

2) Marquer l'emplacement du $^{14}/_{7}$

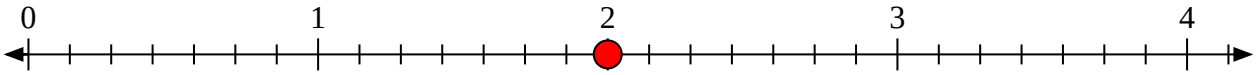

3) Marquer l'emplacement du $^{10}/_{6}$

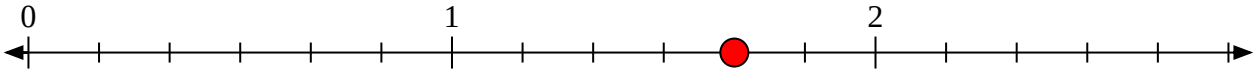

4) Marquer l'emplacement du $^{7}/_{3}$

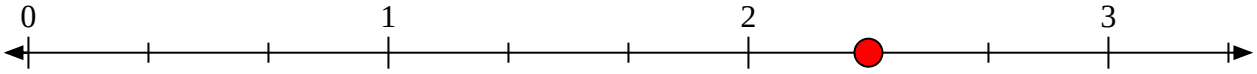

5) Marquer l'emplacement du $^{3}/_{2}$



6) Marquer l'emplacement du $^{11}/_{5}$

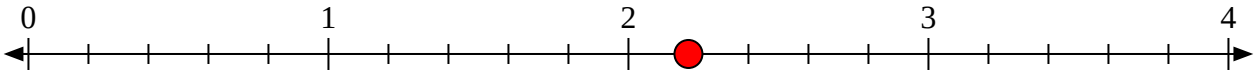

7) Marquer l'emplacement du $^{15}/_{9}$

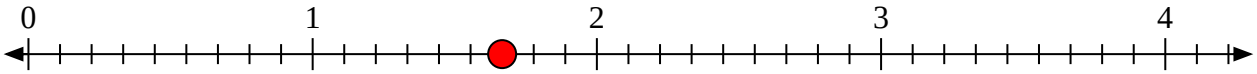

8) Marquer l'emplacement du $^{21}/_{9}$

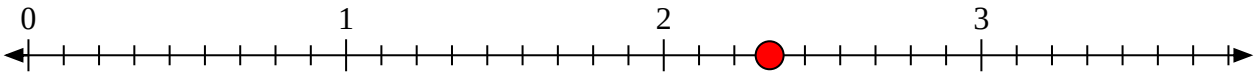

9) Marquer l'emplacement du $^{8}/_{7}$

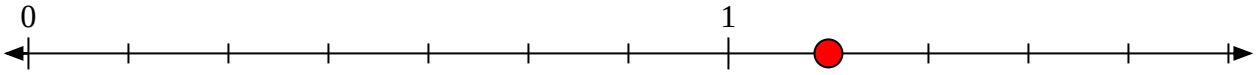

10) Marquer l'emplacement du $^{6}/_{2}$



1-10	90	80	70	60	50	40	30	20	10	0

Résoudre chaque problème.

1) Marquer l'emplacement du $^{3}/_{2}$



2) Marquer l'emplacement du $^{26}/_{9}$

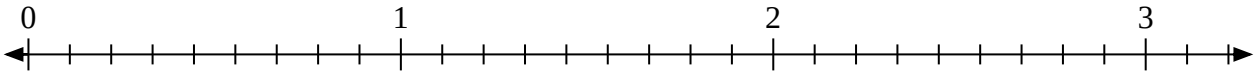

3) Marquer l'emplacement du $^{6}/_{3}$

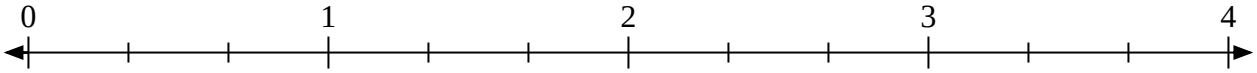

4) Marquer l'emplacement du $^{14}/_{7}$

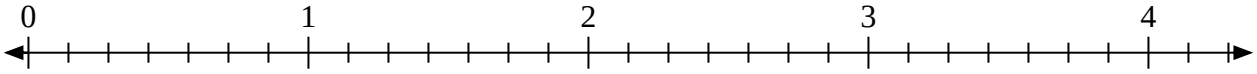

5) Marquer l'emplacement du $^{5}/_{2}$



6) Marquer l'emplacement du $^{22}/_{8}$

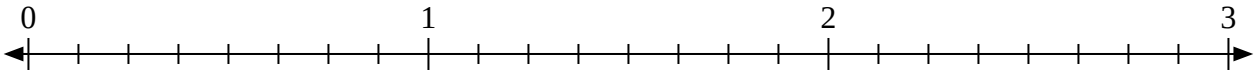

7) Marquer l'emplacement du $^{12}/_{9}$



8) Marquer l'emplacement du $^{11}/_{4}$

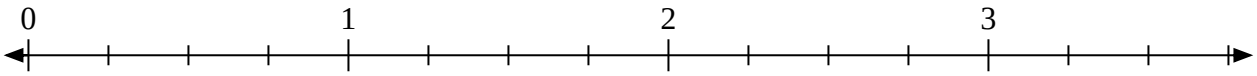

9) Marquer l'emplacement du $^{8}/_{7}$

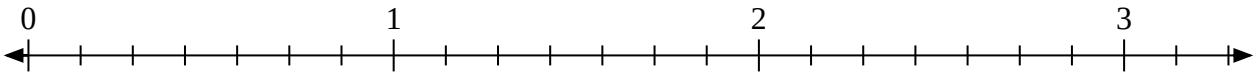

10) Marquer l'emplacement du $^{11}/_{5}$

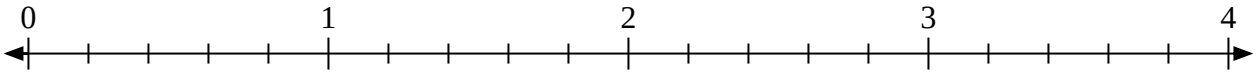

1-10	90	80	70	60	50	40	30	20	10	0

Identifier les fractions et les décimales sur une roue numérique Nom: **Clé**

Résoudre chaque problème.

1) Marquer l'emplacement du $^{3}/_{2}$



2) Marquer l'emplacement du $^{26}/_{9}$

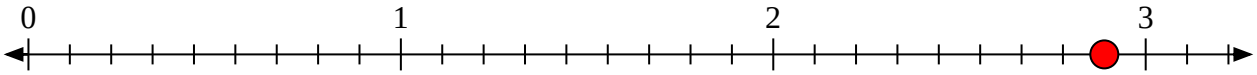

3) Marquer l'emplacement du $^{6}/_{3}$

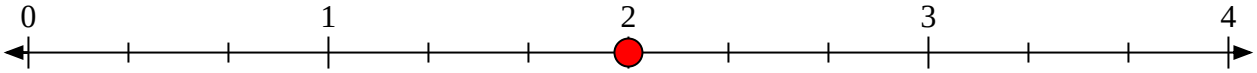

4) Marquer l'emplacement du $^{14}/_{7}$

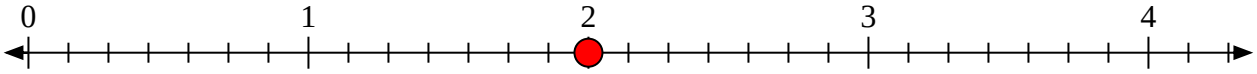

5) Marquer l'emplacement du $^{5}/_{2}$



6) Marquer l'emplacement du $^{22}/_{8}$

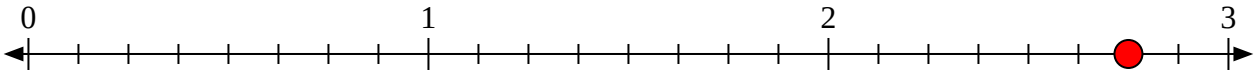

7) Marquer l'emplacement du $^{12}/_{9}$



8) Marquer l'emplacement du $^{11}/_{4}$

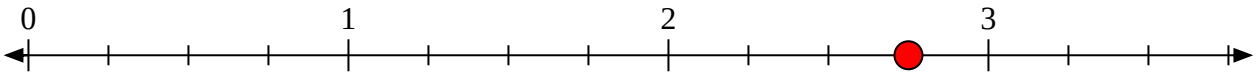

9) Marquer l'emplacement du $^{8}/_{7}$

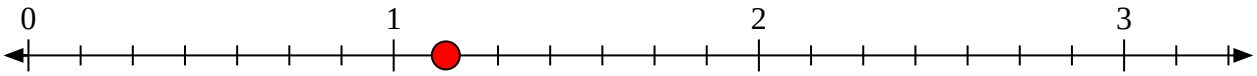

10) Marquer l'emplacement du $^{11}/_{5}$

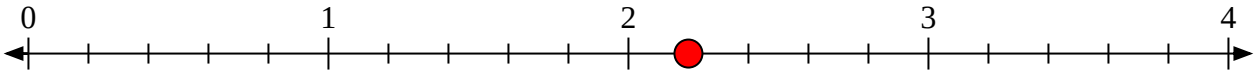

1-10	90	80	70	60	50	40	30	20	10	0

Résoudre chaque problème.

1) Marquer l'emplacement du $^{9}/_{8}$

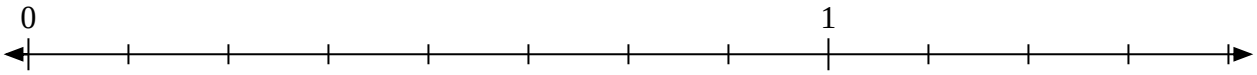

2) Marquer l'emplacement du $^{11}/_{6}$

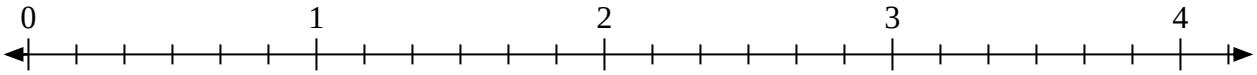

3) Marquer l'emplacement du $^{12}/_{5}$

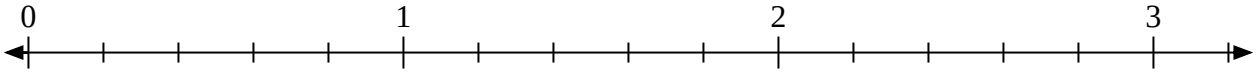

4) Marquer l'emplacement du $^{11}/_{5}$



5) Marquer l'emplacement du $^{4}/_{3}$

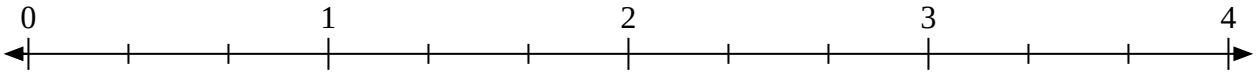

6) Marquer l'emplacement du $^{8}/_{4}$



7) Marquer l'emplacement du $^{5}/_{2}$

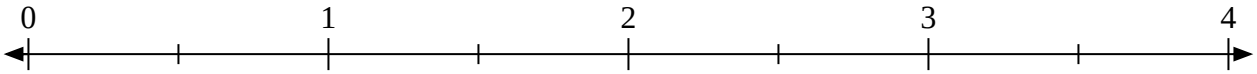

8) Marquer l'emplacement du $^{17}/_{6}$

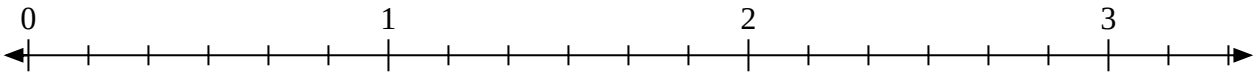

9) Marquer l'emplacement du $^{11}/_{7}$

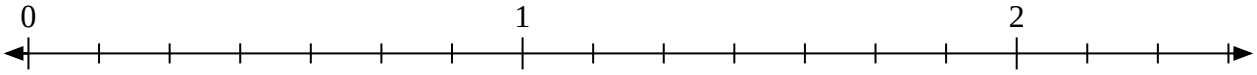

10) Marquer l'emplacement du $^{16}/_{7}$

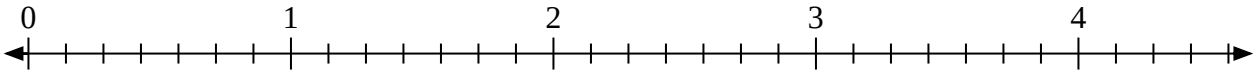

1-10	90	80	70	60	50	40	30	20	10	0

Identifier les fractions et les décimales sur une roue numérique Nom: **Clé**

Résoudre chaque problème.

1) Marquer l'emplacement du $^{9}/_{8}$

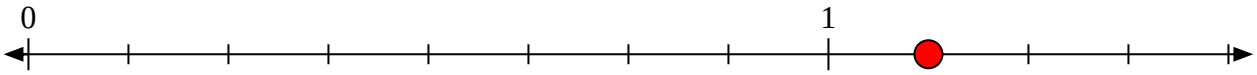

2) Marquer l'emplacement du $^{11}/_{6}$

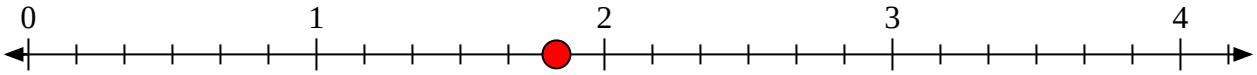

3) Marquer l'emplacement du $^{12}/_{5}$

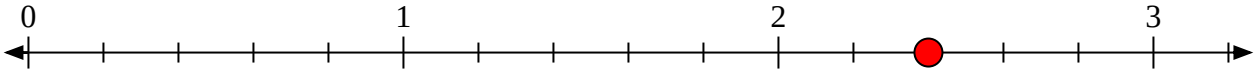

4) Marquer l'emplacement du $^{11}/_{5}$



5) Marquer l'emplacement du $^{4}/_{3}$

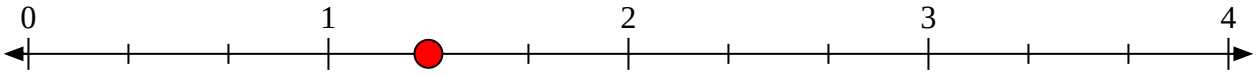

6) Marquer l'emplacement du $^{8}/_{4}$



7) Marquer l'emplacement du $^{5}/_{2}$

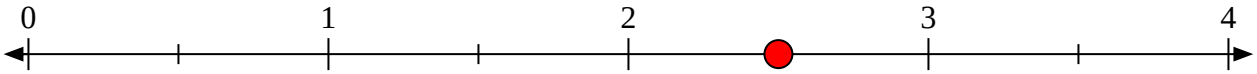

8) Marquer l'emplacement du $^{17}/_{6}$

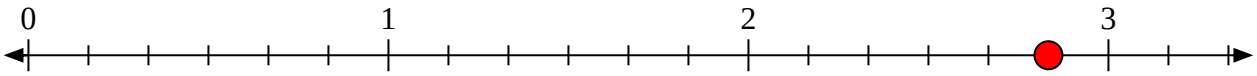

9) Marquer l'emplacement du $^{11}/_{7}$

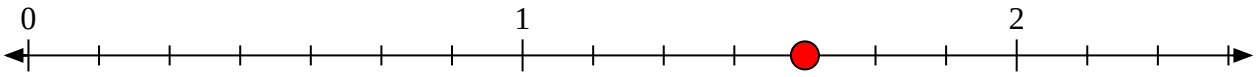

10) Marquer l'emplacement du $^{16}/_{7}$

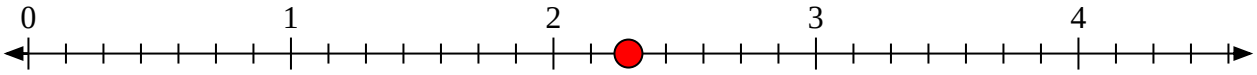

1-10	90	80	70	60	50	40	30	20	10	0

Résoudre chaque problème.

1) Marquer l'emplacement du $^{12}/_{5}$



2) Marquer l'emplacement du $^{5}/_{4}$



3) Marquer l'emplacement du $^{5}/_{2}$



4) Marquer l'emplacement du $^{10}/_{8}$

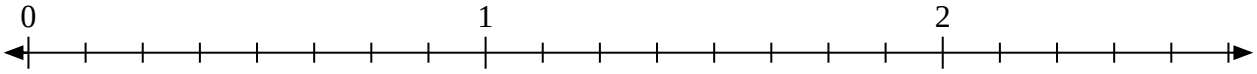

5) Marquer l'emplacement du $^{18}/_{9}$

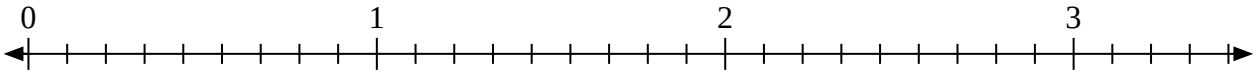

6) Marquer l'emplacement du $^{19}/_{9}$

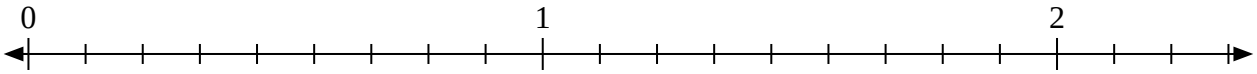

7) Marquer l'emplacement du $^{17}/_{6}$

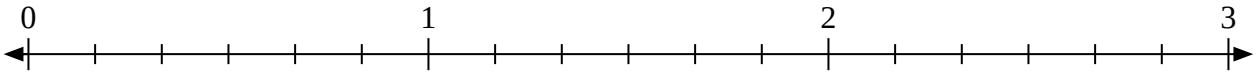

8) Marquer l'emplacement du $^{4}/_{2}$

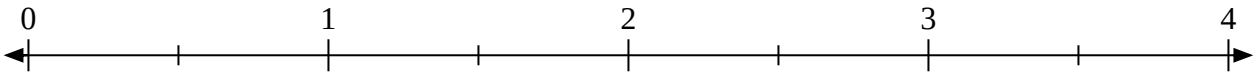

9) Marquer l'emplacement du $^{15}/_{9}$

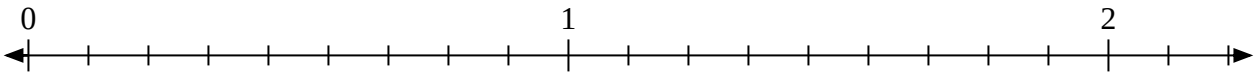

10) Marquer l'emplacement du $^{9}/_{5}$



1-10	90	80	70	60	50	40	30	20	10	0

Identifier les fractions et les décimales sur une roue numérique Nom: **Clé**

Résoudre chaque problème.

1) Marquer l'emplacement du $^{12}/_{5}$



2) Marquer l'emplacement du $^{5}/_{4}$



3) Marquer l'emplacement du $^{5}/_{2}$



4) Marquer l'emplacement du $^{10}/_{8}$

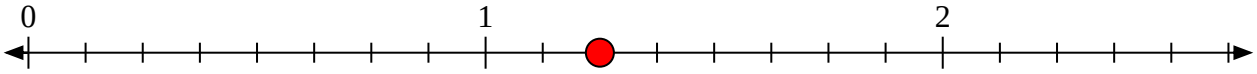

5) Marquer l'emplacement du $^{18}/_{9}$

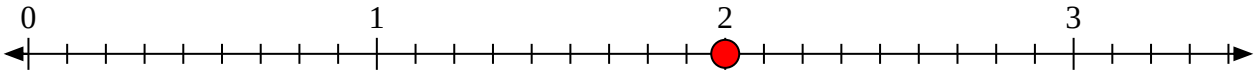

6) Marquer l'emplacement du $^{19}/_{9}$

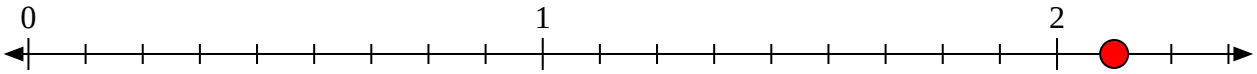

7) Marquer l'emplacement du $^{17}/_{6}$

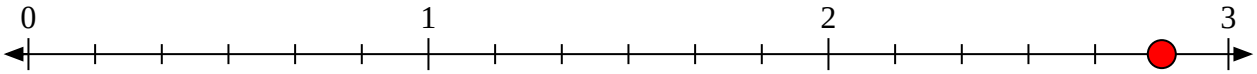

8) Marquer l'emplacement du $^{4}/_{2}$

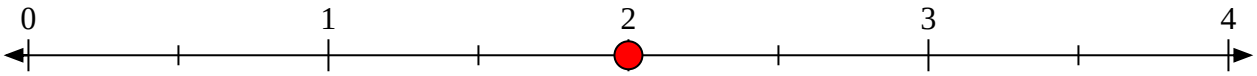

9) Marquer l'emplacement du $^{15}/_{9}$

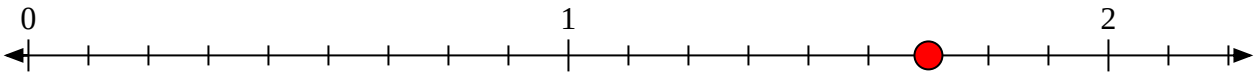

10) Marquer l'emplacement du $^{9}/_{5}$



1-10	90	80	70	60	50	40	30	20	10	0

Résoudre chaque problème.

1) Marquer l'emplacement du $^{9}/_{7}$



2) Marquer l'emplacement du $^{7}/_{6}$

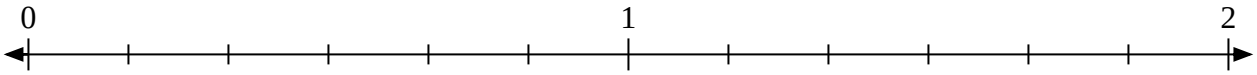

3) Marquer l'emplacement du $^{5}/_{4}$



4) Marquer l'emplacement du $^{23}/_{9}$

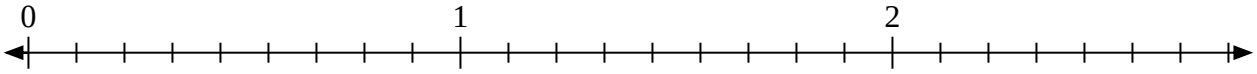

5) Marquer l'emplacement du $^{16}/_{6}$

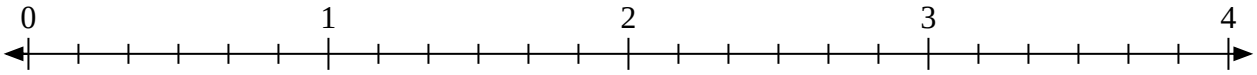

6) Marquer l'emplacement du $^{5}/_{3}$

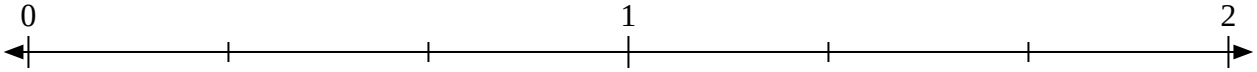

7) Marquer l'emplacement du $^{13}/_{5}$

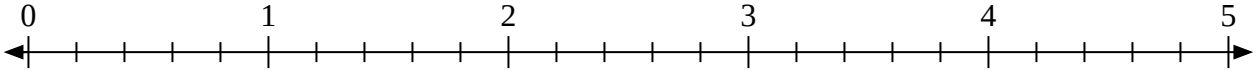

8) Marquer l'emplacement du $^{8}/_{7}$

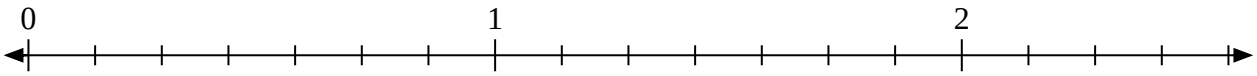

9) Marquer l'emplacement du $^{8}/_{5}$



10) Marquer l'emplacement du $^{5}/_{2}$

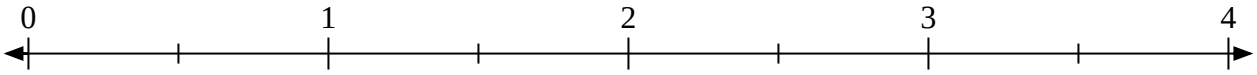

1-10	90	80	70	60	50	40	30	20	10	0

Identifier les fractions et les décimales sur une roue numérique Nom: **Clé**

Résoudre chaque problème.

1) Marquer l'emplacement du $^{9}/_{7}$



2) Marquer l'emplacement du $^{7}/_{6}$

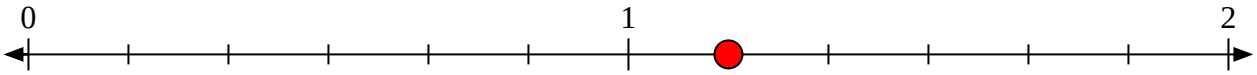

3) Marquer l'emplacement du $^{5}/_{4}$



4) Marquer l'emplacement du $^{23}/_{9}$

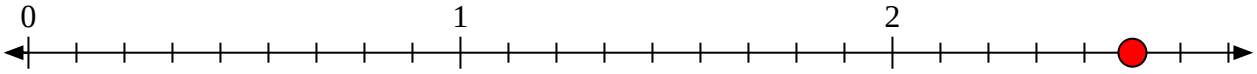

5) Marquer l'emplacement du $^{16}/_{6}$

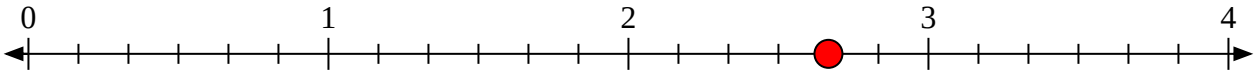

6) Marquer l'emplacement du $^{5}/_{3}$

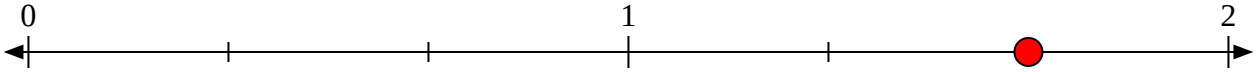

7) Marquer l'emplacement du $^{13}/_{5}$

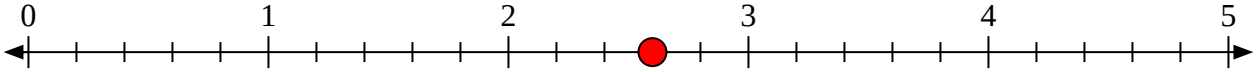

8) Marquer l'emplacement du $^{8}/_{7}$

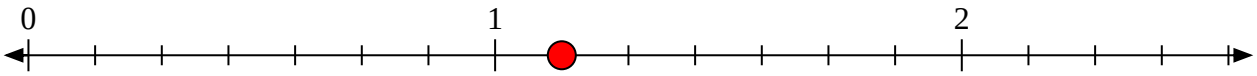

9) Marquer l'emplacement du $^{8}/_{5}$



10) Marquer l'emplacement du $^{5}/_{2}$

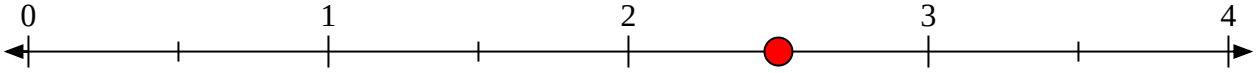

1-10	90	80	70	60	50	40	30	20	10	0

Résoudre chaque problème.

1) Marquer l'emplacement du $^{11}/_{6}$



2) Marquer l'emplacement du $^{14}/_{7}$

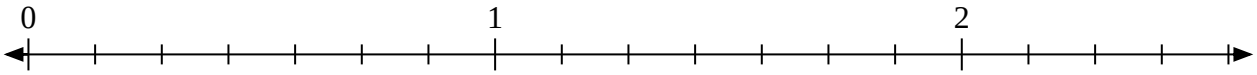

3) Marquer l'emplacement du $^{6}/_{4}$



4) Marquer l'emplacement du $^{11}/_{8}$

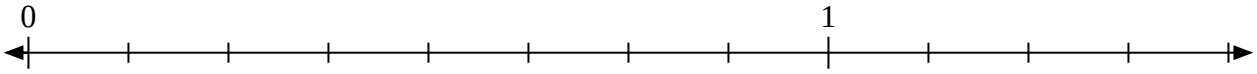

5) Marquer l'emplacement du $^{8}/_{4}$

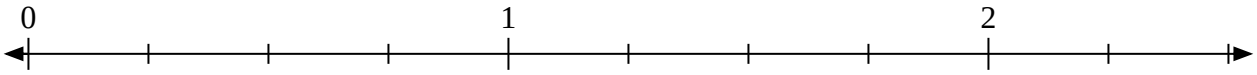

6) Marquer l'emplacement du $^{15}/_{6}$

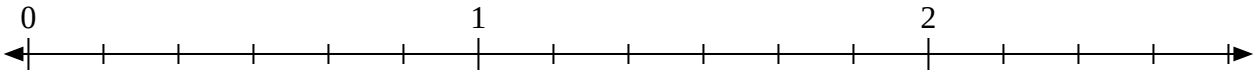

7) Marquer l'emplacement du $^{12}/_{5}$

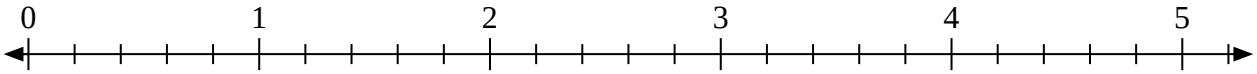

8) Marquer l'emplacement du $^{11}/_{9}$

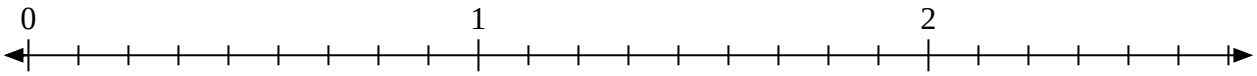

9) Marquer l'emplacement du $^{14}/_{8}$

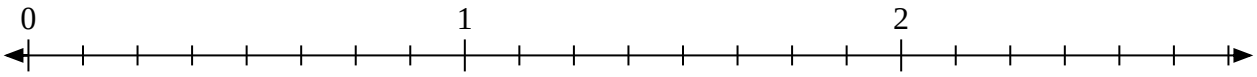

10) Marquer l'emplacement du $^{9}/_{6}$

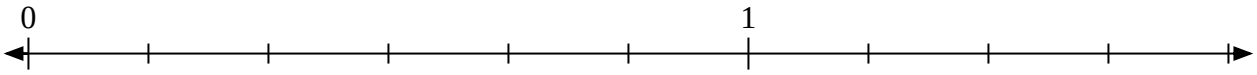

1-10	90	80	70	60	50	40	30	20	10	0

Identifier les fractions et les décimales sur une roue numérique Nom: **Clé**

Résoudre chaque problème.

1) Marquer l'emplacement du $^{11}/_{6}$



2) Marquer l'emplacement du $^{14}/_{7}$

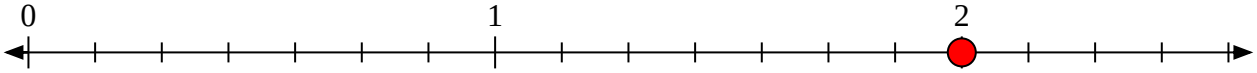

3) Marquer l'emplacement du $^{6}/_{4}$

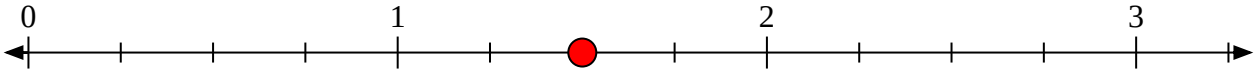

4) Marquer l'emplacement du $^{11}/_{8}$

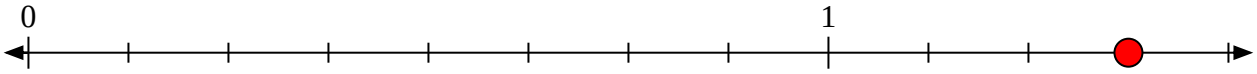

5) Marquer l'emplacement du $^{8}/_{4}$

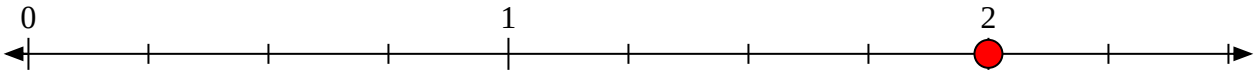

6) Marquer l'emplacement du $^{15}/_{6}$

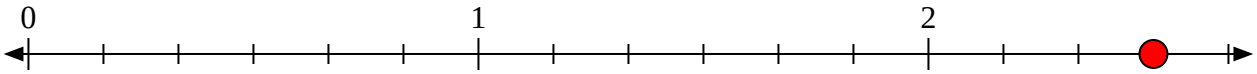

7) Marquer l'emplacement du $^{12}/_{5}$

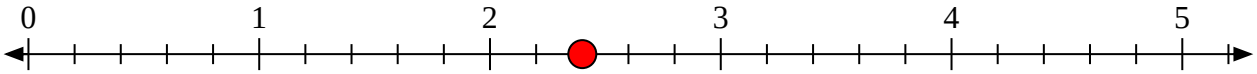

8) Marquer l'emplacement du $^{11}/_{9}$

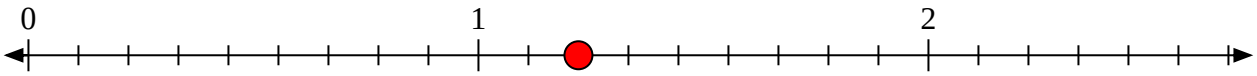

9) Marquer l'emplacement du $^{14}/_{8}$

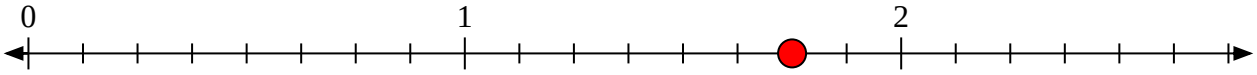

10) Marquer l'emplacement du $^{9}/_{6}$

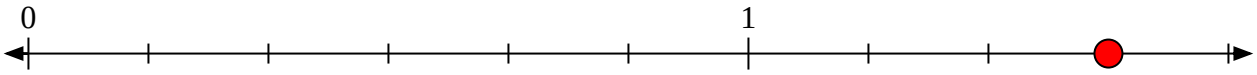

1-10	90	80	70	60	50	40	30	20	10	0