Faire des Mesures Nom:

Mesurez la longueur et la largeur de chaque barre en centimètres.

Ex)

1)



2)



3)



4)

Réponses

Ex.	2 ½	1	6,4	2,5
1.				
2.				
3.				
4.				

1-4	75	50	25	0

Faire des Mesures Nom: **Clé**

Mesurez la longueur et la largeur de chaque barre en centimètres.

Ex)

1)



2)



3)



4)

Réponses

Ex.	2 ½	1	6,4	2,5
1.	4 ½	1 ½	11,4	3,8
2.	3	1	7,6	2,5
3.	5	1 ½	12,7	3,8
4.	2	0 ½	5,1	1,3

1-4	75	50	25	0