Multiplication avec Droites Numériques

Nom:

A l'aide de la droite numérique résoudre chaque problème.

1) $5 \times 7 =$

$7 \times 5 =$

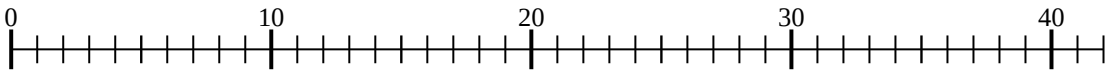

2) $3 \times 7 =$

$7 \times 3 =$

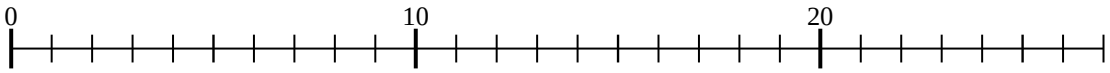

3) $2 \times 6 =$

$6 \times 2 =$

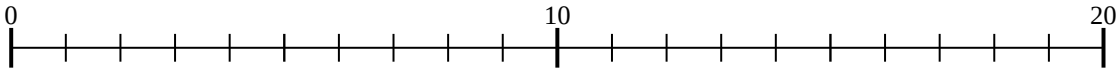

4) $3 \times 2 =$

$2 \times 3 =$

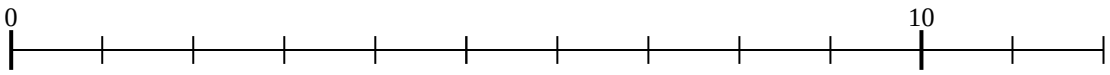

5) $4 \times 8 =$

$8 \times 4 =$

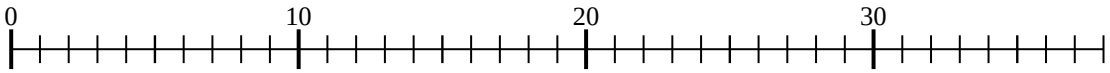

6) $5 \times 2 =$

$2 \times 5 =$

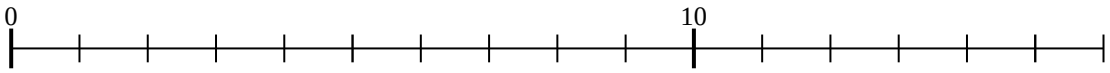

7) $5 \times 8 =$

$8 \times 5 =$

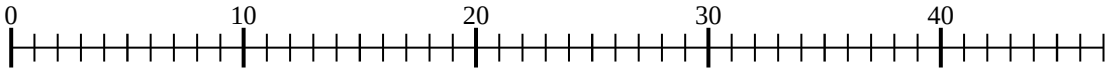

8) $2 \times 7 =$

$7 \times 2 =$

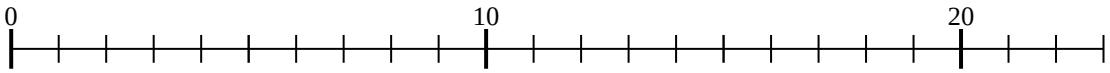

9) $2 \times 5 =$

$5 \times 2 =$

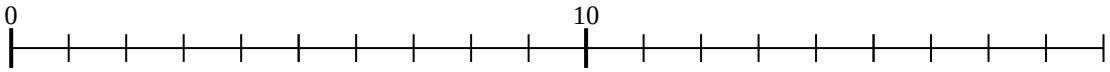

10) $2 \times 9 =$

$9 \times 2 =$

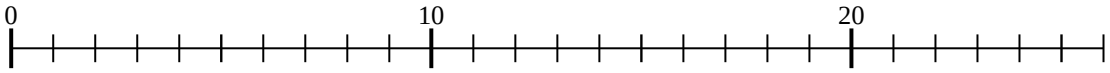

11) $4 \times 6 =$

$6 \times 4 =$

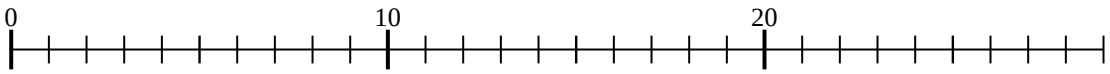

Réponses

1. _____
2. _____
3. _____
4. _____
5. _____
6. _____
7. _____
8. _____
9. _____
10. _____
11. _____

1-10	91	82	73	64	55	45	36	27	18	9
11	0									

Multiplication avec Droites Numériques Nom: **Clé**

A l'aide de la droite numérique résoudre chaque problème.

1) $5 \times 7 =$

$7 \times 5 =$

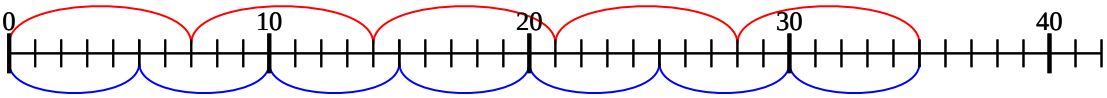

2) $3 \times 7 =$

$7 \times 3 =$

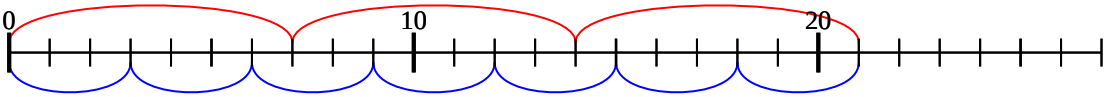

3) $2 \times 6 =$

$6 \times 2 =$

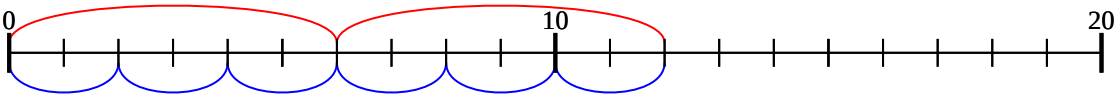

4) $3 \times 2 =$

$2 \times 3 =$

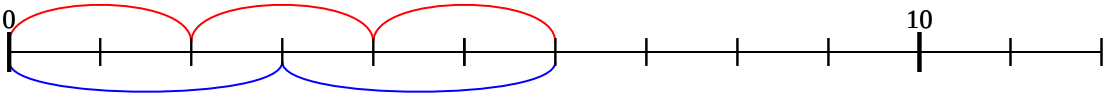

5) $4 \times 8 =$

$8 \times 4 =$

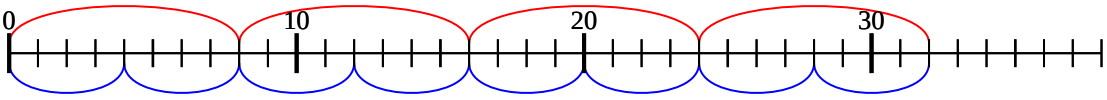

6) $5 \times 2 =$

$2 \times 5 =$

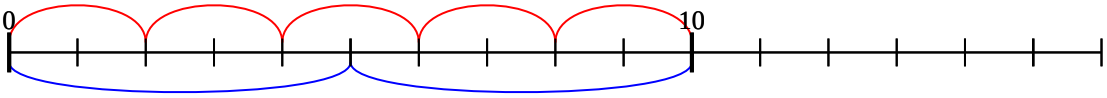

7) $5 \times 8 =$

$8 \times 5 =$

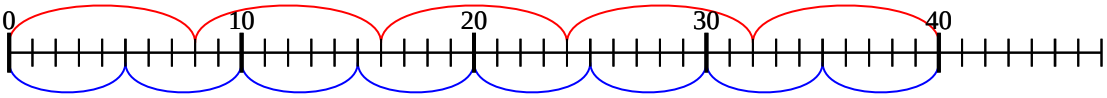

8) $2 \times 7 =$

$7 \times 2 =$

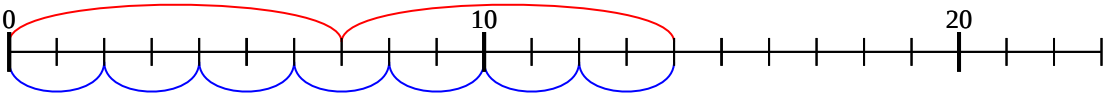

9) $2 \times 5 =$

$5 \times 2 =$

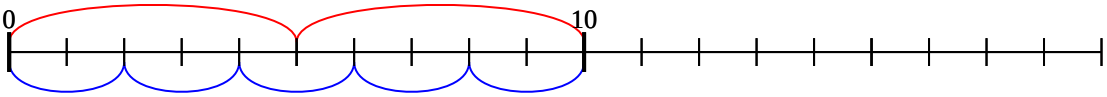

10) $2 \times 9 =$

$9 \times 2 =$

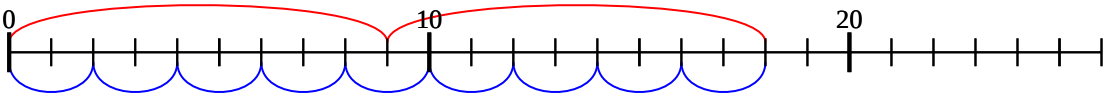

11) $4 \times 6 =$

$6 \times 4 =$

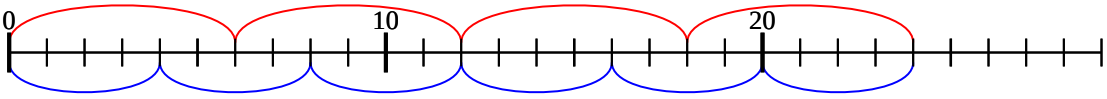

Réponses

1. **35**
2. **21**
3. **12**
4. **6**
5. **32**
6. **10**
7. **40**
8. **14**
9. **10**
10. **18**
11. **24**

1-10	91	82	73	64	55	45	36	27	18	9
11	0									