Transcription en Multiplication

Nom:

Exprimez chaque groupes d'objets en multiplication.

Ex)



1)

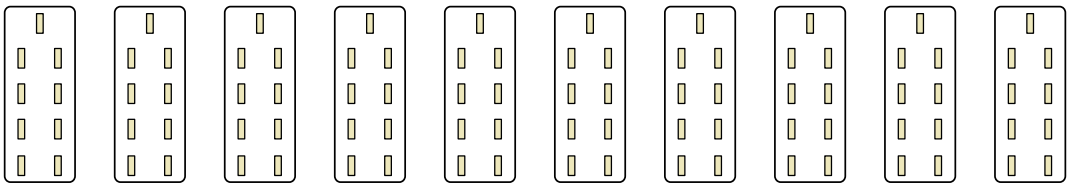

2)

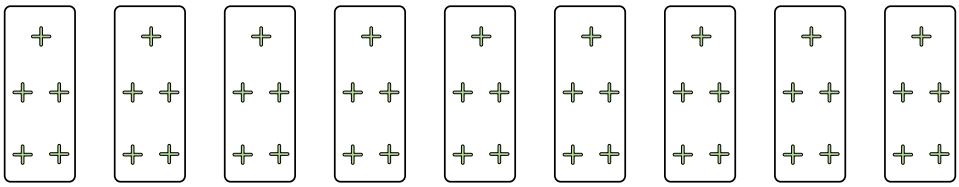

3)



4)

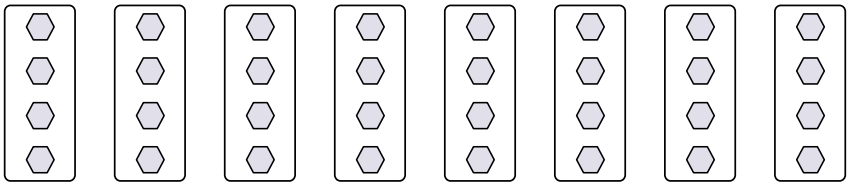

5)

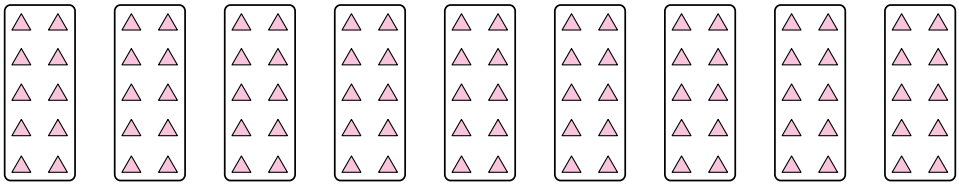

6)

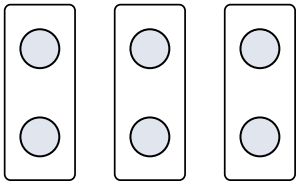

7)



8)

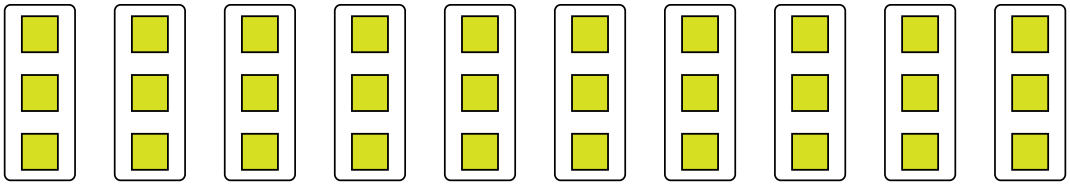

Réponses

Ex. **6×3=18**

1. _____
2. _____
3. _____
4. _____
5. _____
6. _____
7. _____
8. _____

1-8	88	75	63	50	38	25	13	0

Transcription en Multiplication Nom: **Clé**

Exprimez chaque groupes d'objets en multiplication.

Ex)



1)

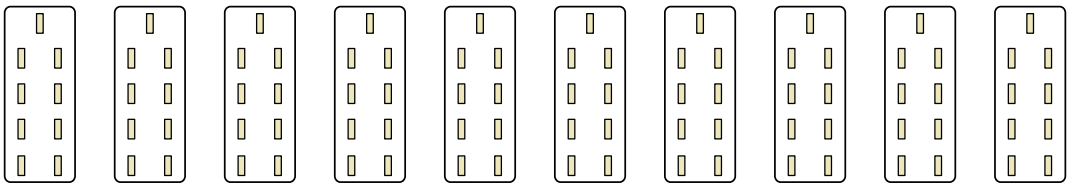

2)

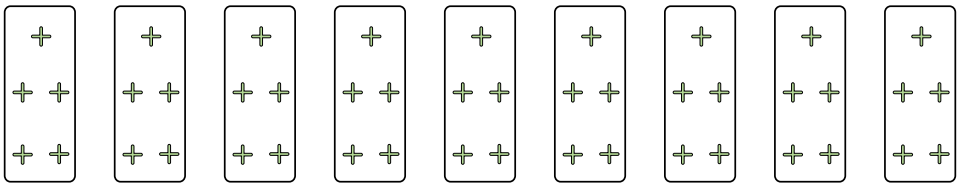

3)



4)

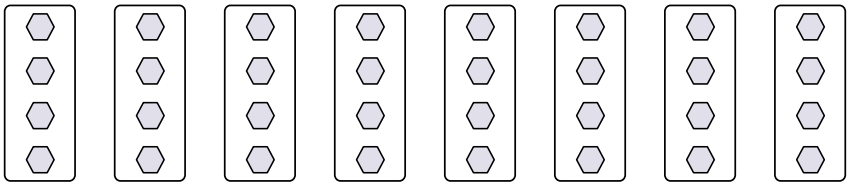

5)

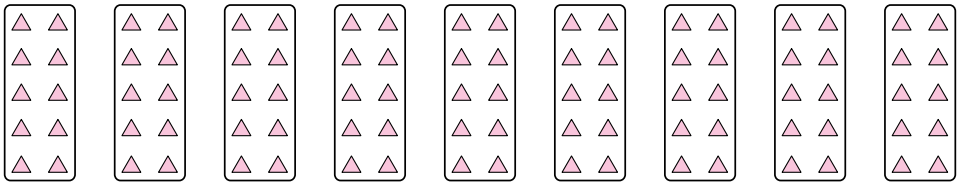

6)

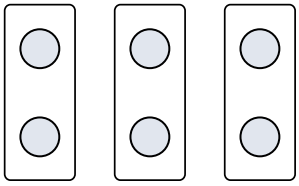

7)



8)

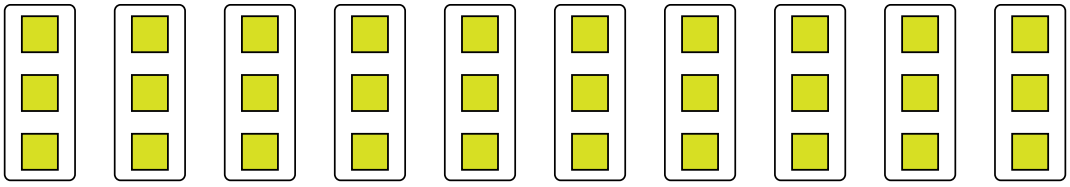

Réponses

Ex. **6×3=18**

1. **10×9=90**
2. **9×5=45**
3. **5×2=10**
4. **8×4=32**
5. **9×10=90**
6. **3×2=6**
7. **4×9=36**
8. **10×3=30**

1-8	88	75	63	50	38	25	13	0