Transcription en Multiplication Nom:

Exprimez chaque groupes d'objets en multiplication.

Ex) 

1) 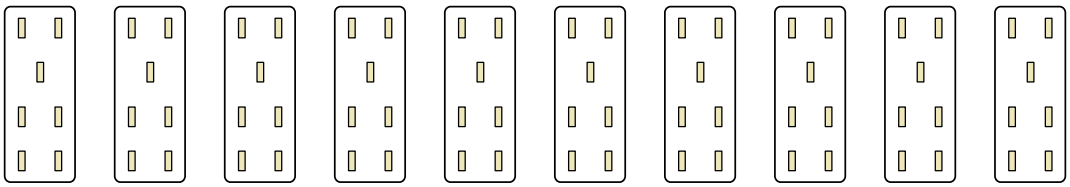

2) 

3) 

4) 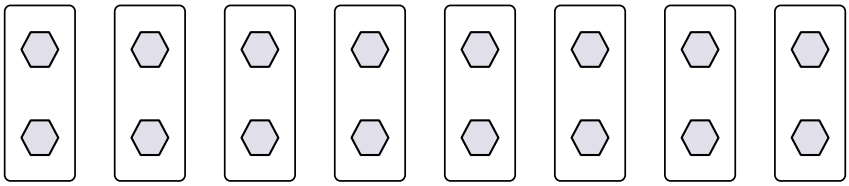

5) 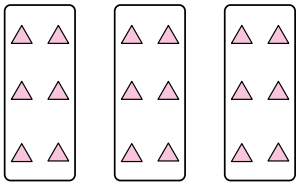

6) 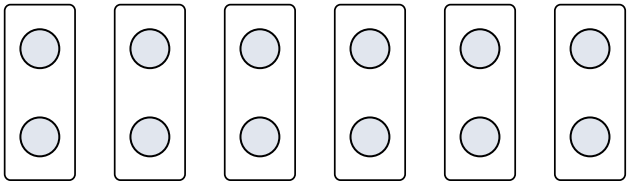

7) 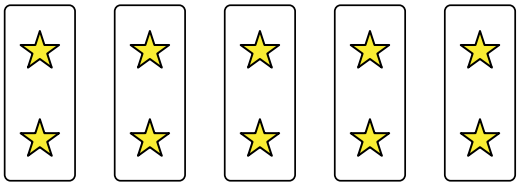

8) 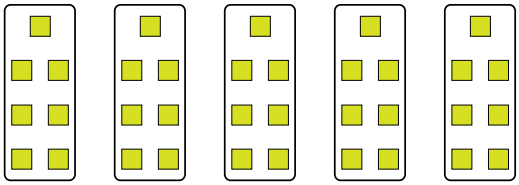

Réponses

Ex. 10×10=100

1. _____

2. _____

3. _____

4. _____

5. _____

6. _____

7. _____

8. _____

1-8	88	75	63	50	38	25	13	0

Transcription en Multiplication Nom: **Clé**

Exprimez chaque groupes d'objets en multiplication.

Ex)



1)

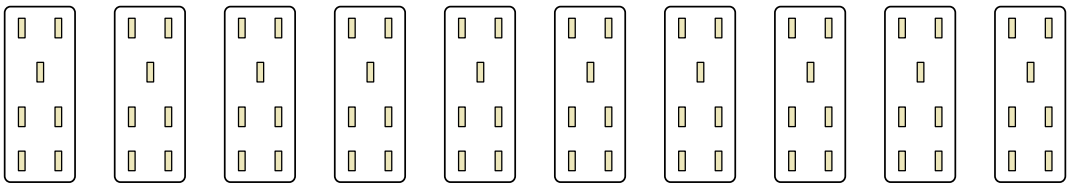

2)



3)



4)

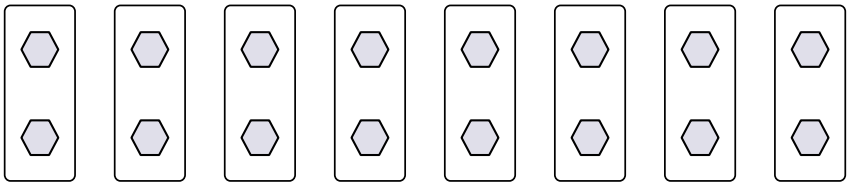

5)

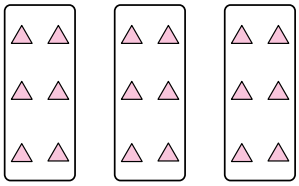

6)

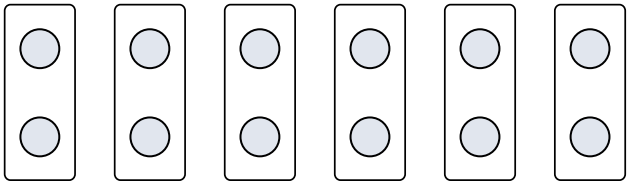

7)

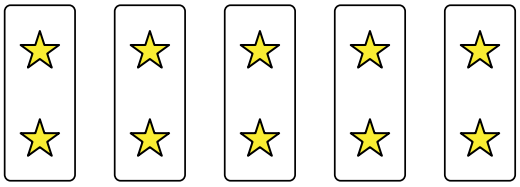

8)



Réponses

Ex. 10×10=100

1. 10×7=70
2. 4×7=28
3. 10×6=60
4. 8×2=16
5. 3×6=18
6. 6×2=12
7. 5×2=10
8. 5×7=35

1-8	88	75	63	50	38	25	13	0