Réécriture de Multiplication (Visuelle)

Nom:

Interpréter chaque figure en multiplication.

Ex) 

1)

2)

3) 

4) 

5)

6) 

7) 

8)

9) 

10) 

11)

Réponses

Ex. **2 × 5 = 10**

1. _____
2. _____
3. _____
4. _____
5. _____
6. _____
7. _____
8. _____
9. _____
10. _____
11. _____

1-10	91	82	73	64	55	45	36	27	18	9
11	0									

Réécriture de Multiplication (Visuelle) Nom: **Clé**

Interpréter chaque figure en multiplication.

Ex) 

1)

2)

3) 

4) 

5)

6) 

7) 

8)

9) 

10) 

11)

Réponses

Ex. **2 × 5 = 10**

1. **6 × 10 = 60**
2. **3 × 7 = 21**
3. **10 × 3 = 30**
4. **3 × 8 = 24**
5. **7 × 3 = 21**
6. **9 × 5 = 45**
7. **9 × 6 = 54**
8. **4 × 10 = 40**
9. **6 × 9 = 54**
10. **6 × 5 = 30**
11. **2 × 3 = 6**

1-10	91	82	73	64	55	45	36	27	18	9
11	0									