Réécriture de Multiplication (Visuelle)

Nom:

Interpréter chaque figure en multiplication.

Ex) 

1)

2) 

3)

4)

5)

6) 

7) 

8)

9) 

10)

11) 

Réponses

Ex. 9 × 5 = 45

1. _____
2. _____
3. _____
4. _____
5. _____
6. _____
7. _____
8. _____
9. _____
10. _____
11. _____

1-10	91	82	73	64	55	45	36	27	18	9
11	0									

Réécriture de Multiplication (Visuelle) Nom: **Clé**

Interpréter chaque figure en multiplication.

Ex) 

1)

2) 

3)

4)

5)

6) 

7) 

8)

9) 

10)

11) 

Réponses

Ex. **9 × 5 = 45**

1. **8 × 2 = 16**
2. **6 × 9 = 54**
3. **3 × 7 = 21**
4. **2 × 9 = 18**
5. **3 × 4 = 12**
6. **8 × 10 = 80**
7. **10 × 9 = 90**
8. **2 × 10 = 20**
9. **4 × 2 = 8**
10. **3 × 6 = 18**
11. **10 × 5 = 50**

1-10	91	82	73	64	55	45	36	27	18	9
11	0									