**Déterminez ce que la valeur de A signifie dans chaque problème.**

**1)**

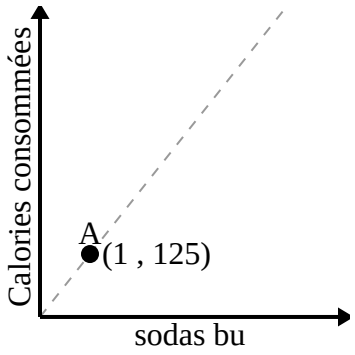


**2)**

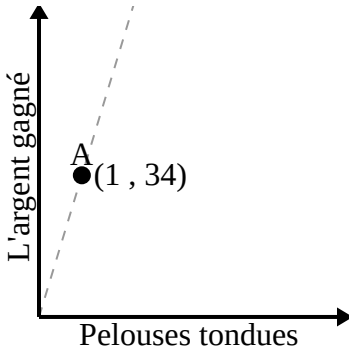


**3)**

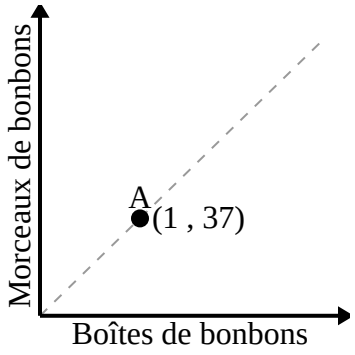


**4)**

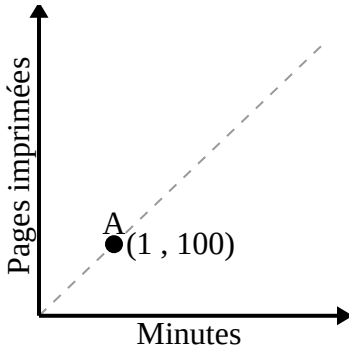


**5)**

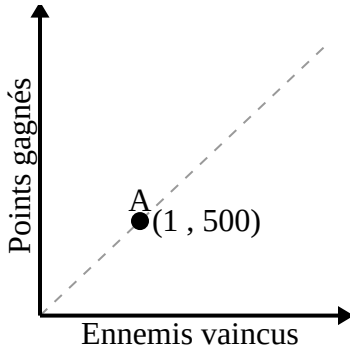


**6)**

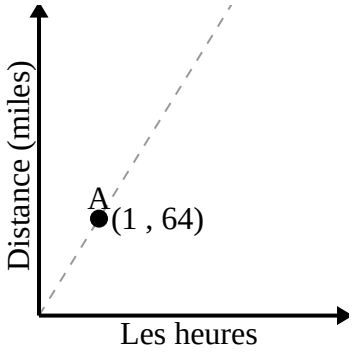




| 1-6 | 83 | 67 | 50 | 33 | 17 | 0 |
|---|---|---|---|---|---|---|

**Déterminez ce que la valeur de A signifie dans chaque problème.**

**1)**

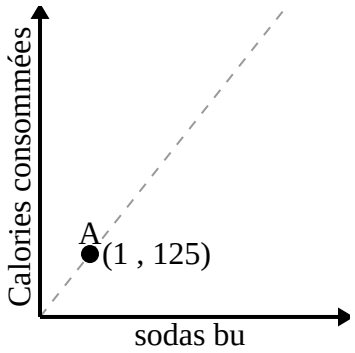


Pour chaque soda bu 125 calories sont consommées.

**2)**

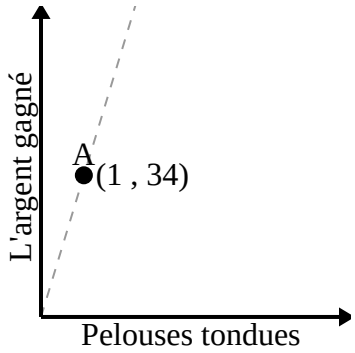


Pour chaque pelouse tondue, vous gagnez 34 $.

**3)**

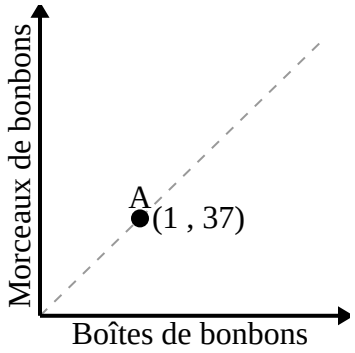


Chaque boîte de bonbons contient 37 morceaux de bonbons.

**4)**

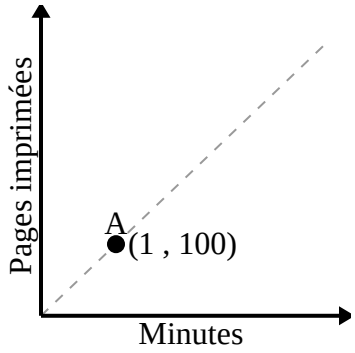


Chaque minute 100 pages sont imprimées.

**5)**

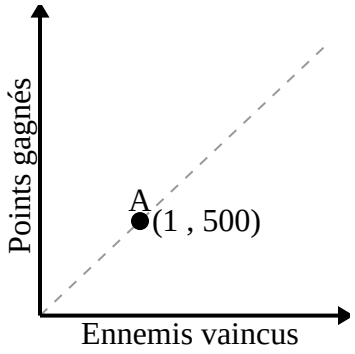


Pour chaque ennemi vaincu 500 points sont gagnés.

**6)**

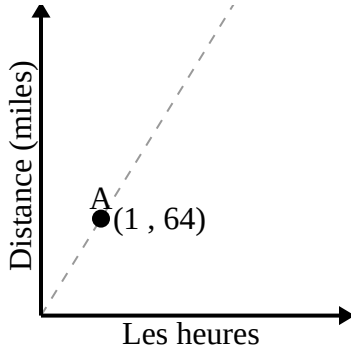


Toutes les heures, 64 miles sont parcourus.



| 1-6 | 83 | 67 | 50 | 33 | 17 | 0 |
|---|---|---|---|---|---|---|