Déterminez ce que la valeur de A signifie dans chaque problème.

1)

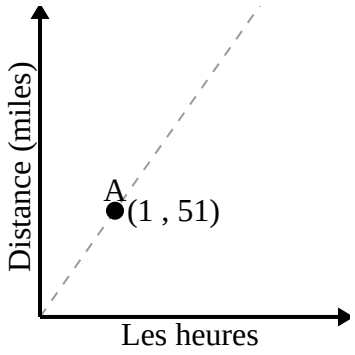

2)

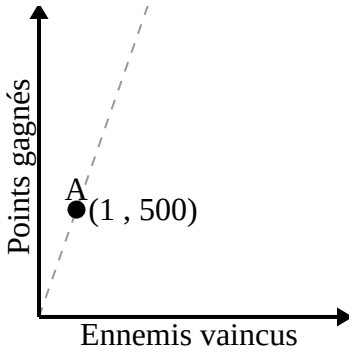

3)

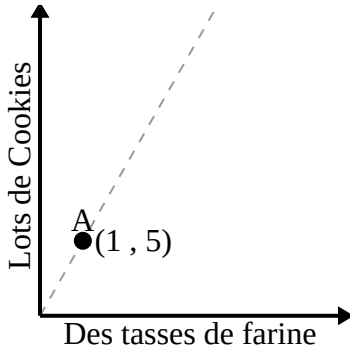

4)

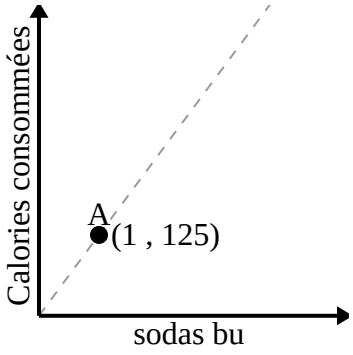

5)

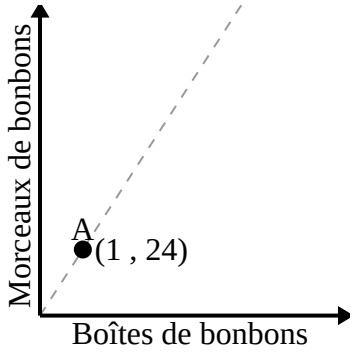

6)

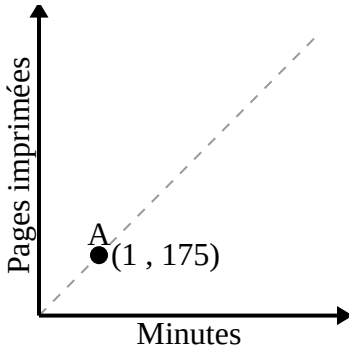

1-6	83	67	50	33	17	0

Déterminez ce que la valeur de A signifie dans chaque problème.

1)

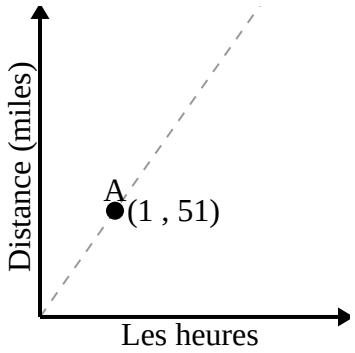

Toutes les heures, 51 miles sont parcourus.

2)

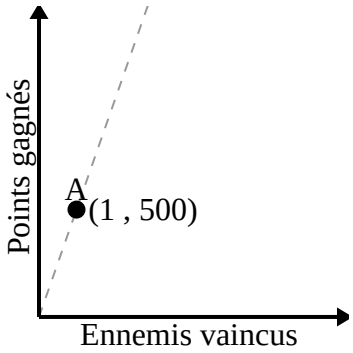

Pour chaque ennemi vaincu 500 points sont gagnés.

3)

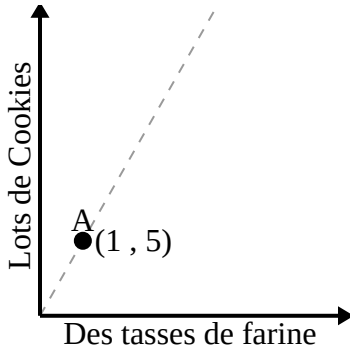

Pour chaque tasse de farine 5, des lots de biscuits peuvent être préparés.

4)

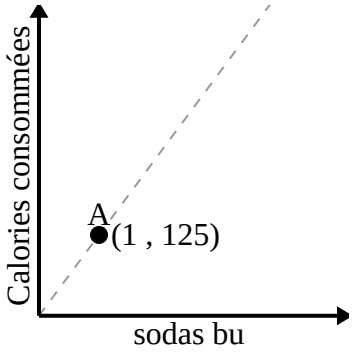

Pour chaque soda bu 125 calories sont consommées.

5)

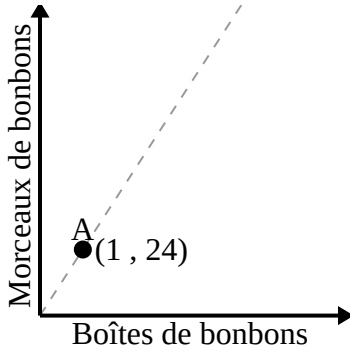

Chaque boîte de bonbons contient 24 morceaux de bonbons.

6)

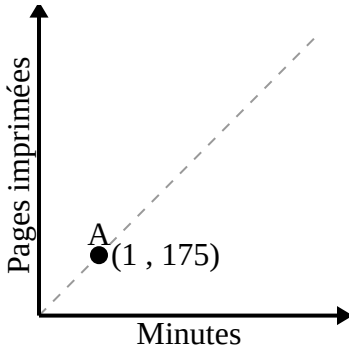

Chaque minute 175 pages sont imprimées.

1-6	83	67	50	33	17	0