Identifier des Polygones Réguliers et Irréguliers

Nom:

Déterminer si la figure est régulière ou irrégulière.

1)

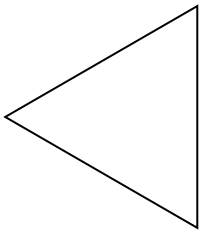

2)

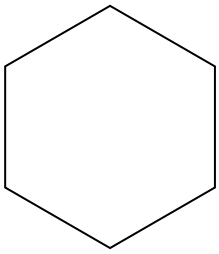

3)



4)

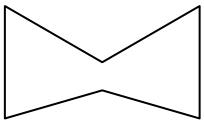

5)



6)

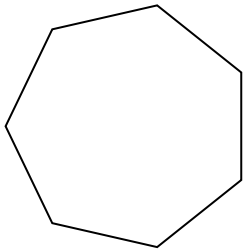

7)

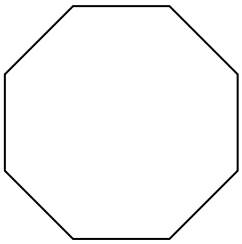

8)



9)

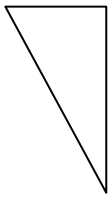

10)

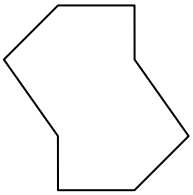

11)

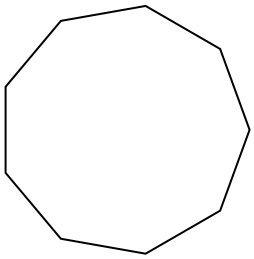

12)

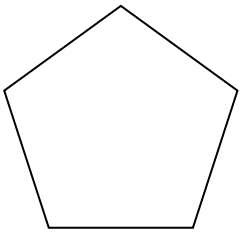

13)



14)



15)

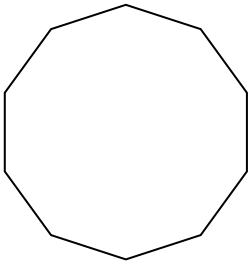

Réponses

1. _____
2. _____
3. _____
4. _____
5. _____
6. _____
7. _____
8. _____
9. _____
10. _____
11. _____
12. _____
13. _____
14. _____
15. _____

1-10	93	87	80	73	67	60	53	47	40	33
11-15	27	20	13	7	0					

Identifier des Polygones Réguliers et Irréguliers Nom: **Clé**

Déterminer si la figure est régulière ou irrégulière.

1)

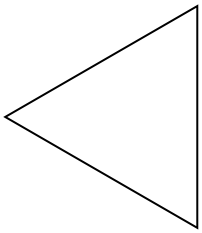

2)

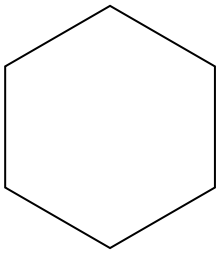

3)



4)

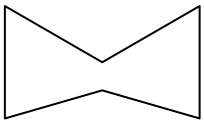

5)



6)

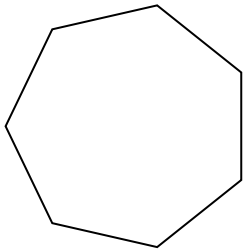

7)

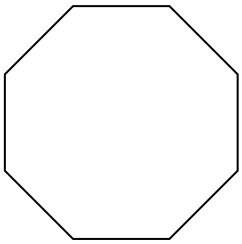

8)



9)

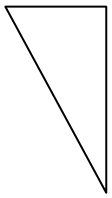

10)

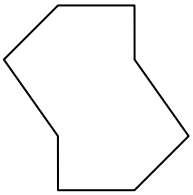

11)

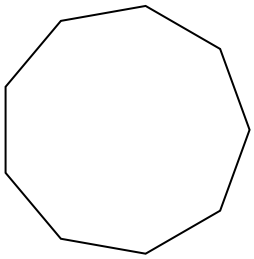

12)

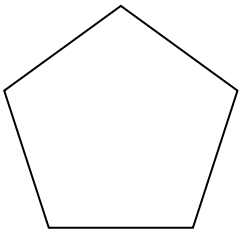

13)



14)



15)

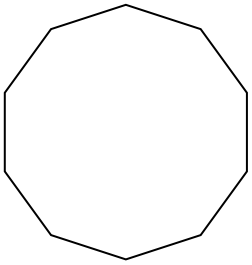

Réponses

1. régulière
2. régulière
3. irrégulière
4. irrégulière
5. irrégulière
6. régulière
7. régulière
8. régulière
9. irrégulière
10. irrégulière
11. régulière
12. régulière
13. irrégulière
14. irrégulière
15. régulière

1-10	93	87	80	73	67	60	53	47	40	33
11-15	27	20	13	7	0					