**Déterminez la forme 2D qui serait créée si la forme 3D était découpée comme indiqué.**

**1)**

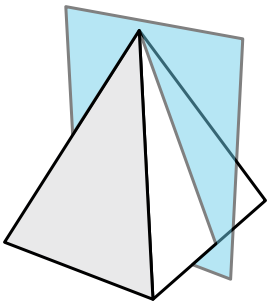

**2)**

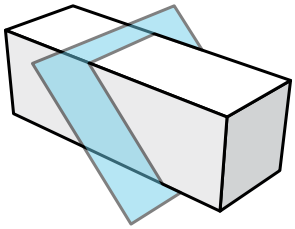

**3)**

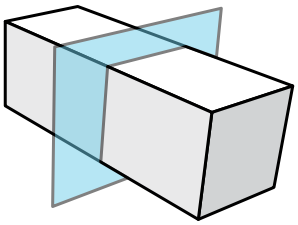

**4)**

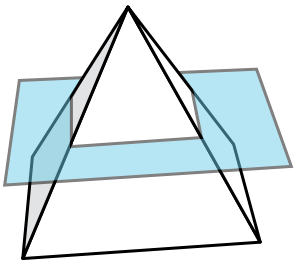

**5)**

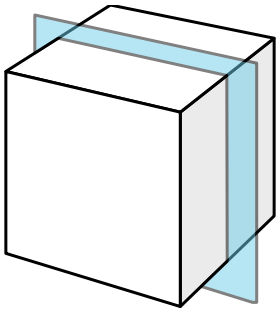

**6)**

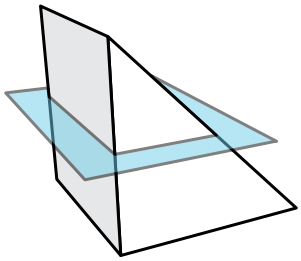

**7)**

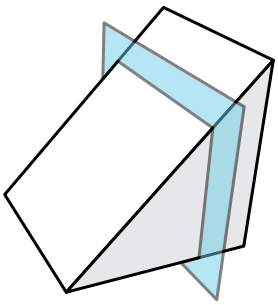

**8)**

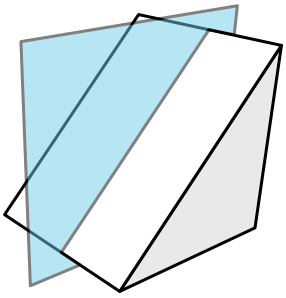

**9)**

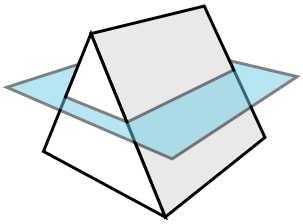



| 1-9 | 89 | 78 | 67 | 56 | 44 | 33 | 22 | 11 | 0 |
|---|---|---|---|---|---|---|---|---|---|

Découpe de formes 3D Nom: **Clé**

**Déterminez la forme 2D qui serait créée si la forme 3D était découpée comme indiqué.**

**1)**

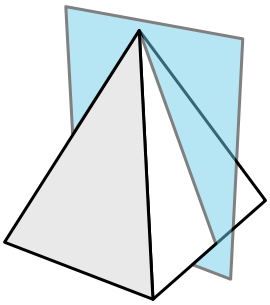



**2)**

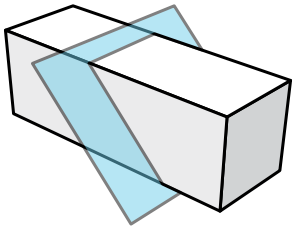



**3)**

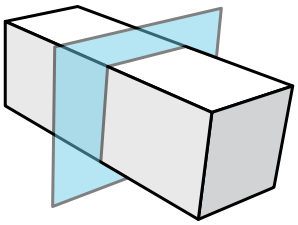



**4)**

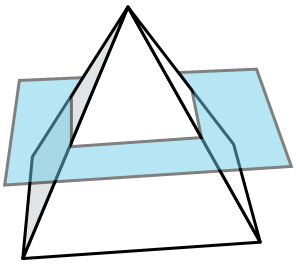



**5)**

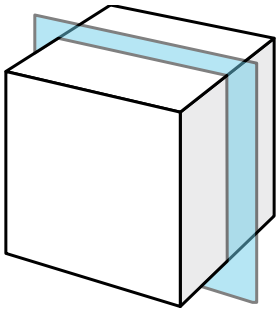



**6)**

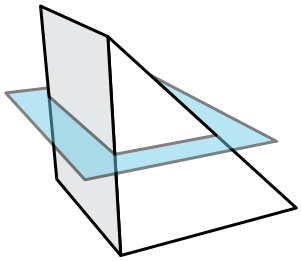



**7)**

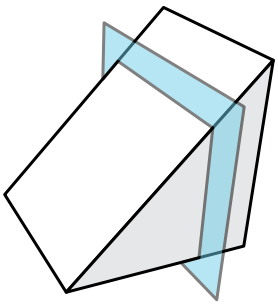

**8)**

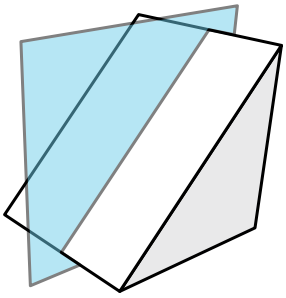

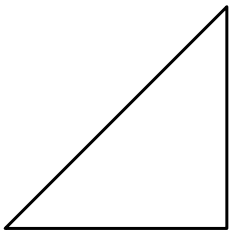

**9)**

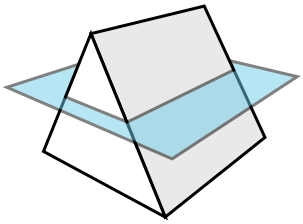





| 1-9 | 89 | 78 | 67 | 56 | 44 | 33 | 22 | 11 | 0 |
|---|---|---|---|---|---|---|---|---|---|