Création d'horloges Nom:

**Dessinez l'aiguille des heures et des minutes sur l'horloge pour qu'elle représente l'heure indiquée.**

**1)** 10:15

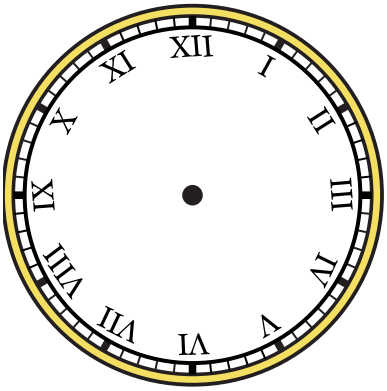


**2)** 1:45

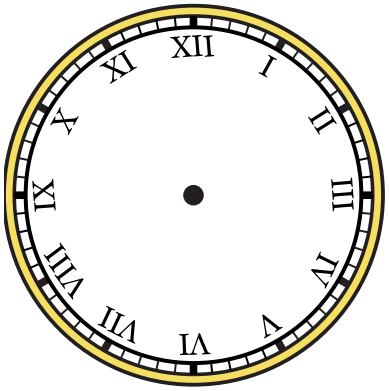


**3)** 6:30

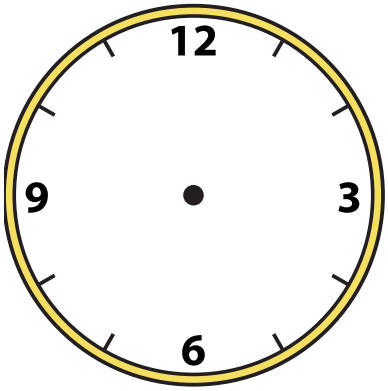


**4)** 5:30



**5)** 7:45



**6)** 10:00

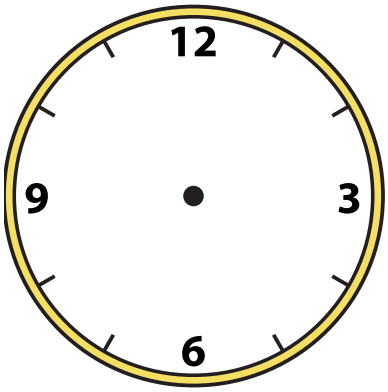


**7)** 1:00



**8)** 12:30

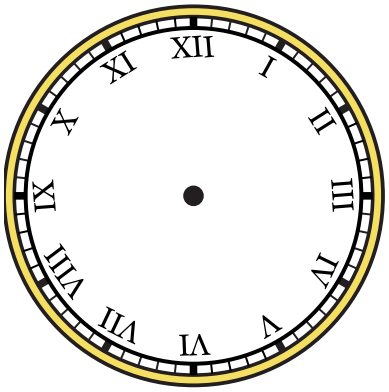


**9)** 9:15

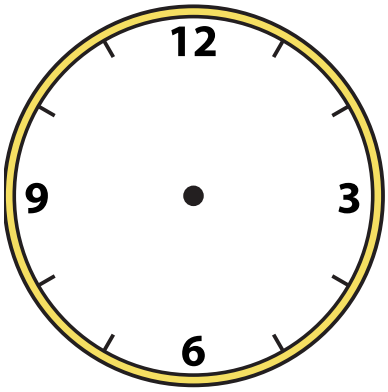

Création d'horloges Nom: **Clé**

**Dessinez l'aiguille des heures et des minutes sur l'horloge pour qu'elle représente l'heure indiquée.**

**1)** 10:15




**2)** 1:45




**3)** 6:30




**4)** 5:30

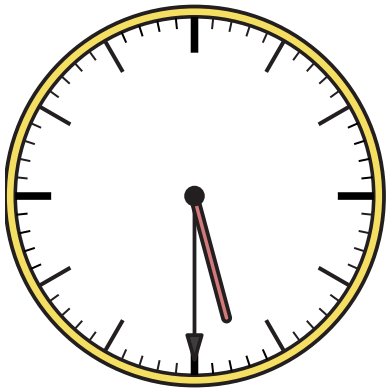

**5)** 7:45

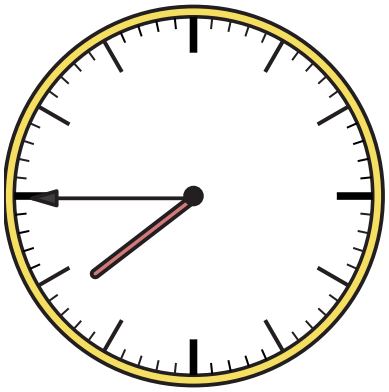

**6)** 10:00




**7)** 1:00



**8)** 12:30

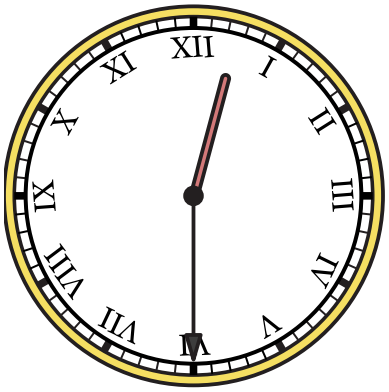


**9)** 9:15






| 1-9 | 89 | 78 | 67 | 56 | 44 | 33 | 22 | 11 | 0 |
|---|---|---|---|---|---|---|---|---|---|