Dessinez l'aiguille des heures et des minutes sur l'horloge pour qu'elle représente l'heure indiquée.

1) 12:20

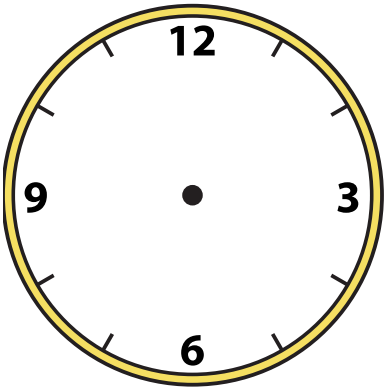

2) 6:40

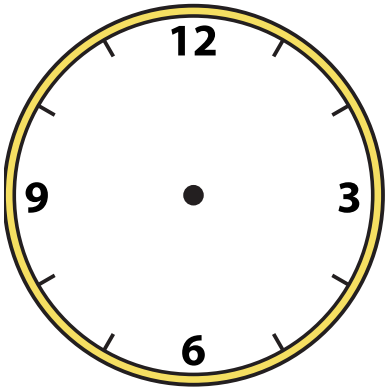

3) 7:15

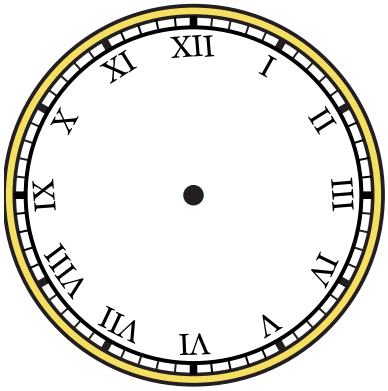

4) 8:50

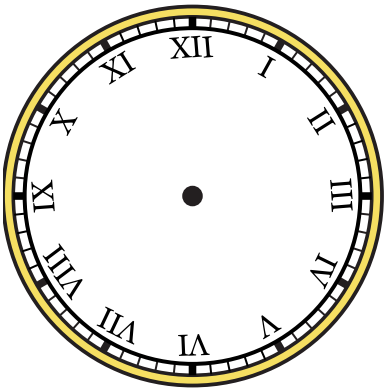

5) 2:05



6) 2:00

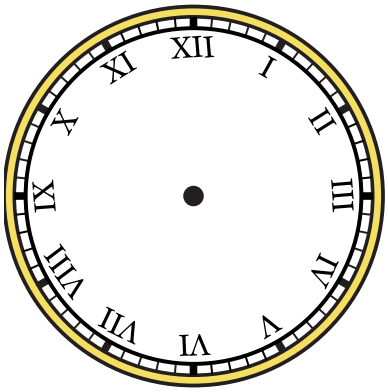

7) 12:25

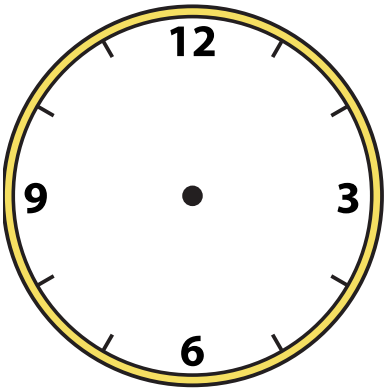

8) 2:35



9) 9:30



1-9	89	78	67	56	44	33	22	11	0

Dessinez l'aiguille des heures et des minutes sur l'horloge pour qu'elle représente l'heure indiquée.

1) 12:20



2) 6:40



3) 7:15

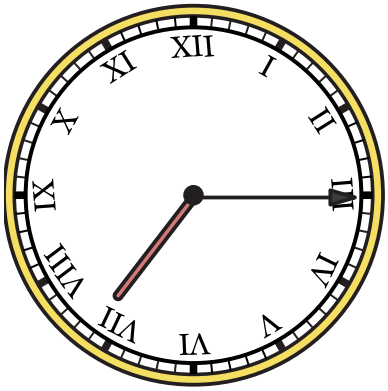

4) 8:50



5) 2:05

6) 2:00



7) 12:25



8) 2:35

9) 9:30

1-9	89	78	67	56	44	33	22	11	0