Création d'horloges Nom:

Dessinez l'aiguille des heures et des minutes sur l'horloge pour qu'elle représente l'heure indiquée.

1) 3:45



2) 3:10

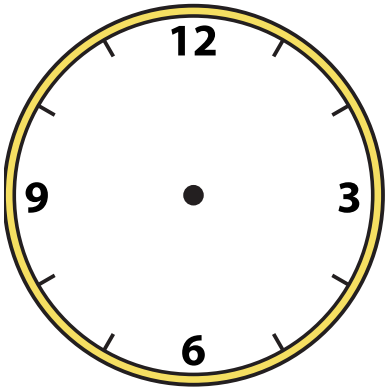

3) 4:40

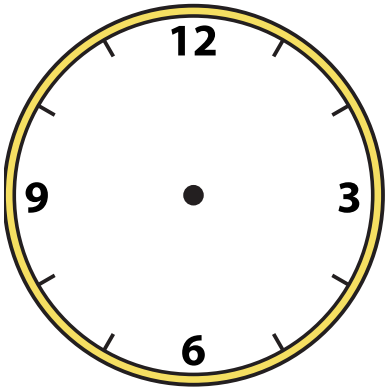

4) 8:30

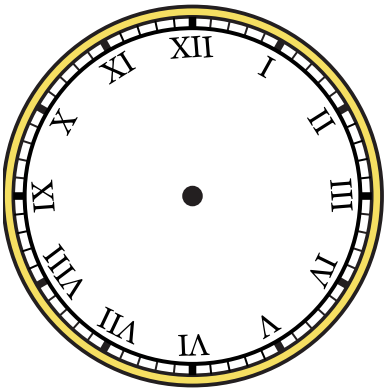

5) 1:45

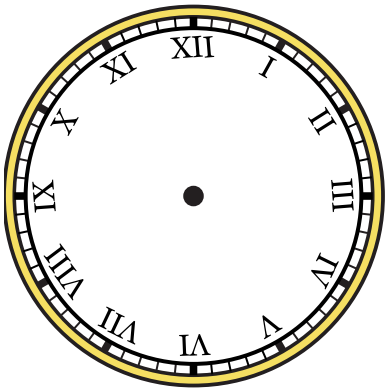

6) 9:20



7) 7:20

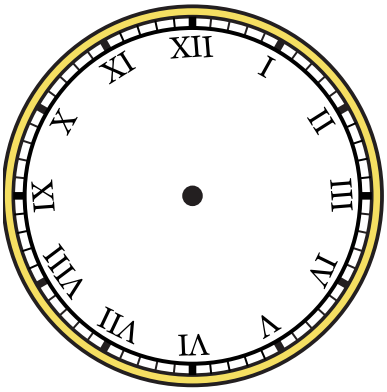

8) 4:55

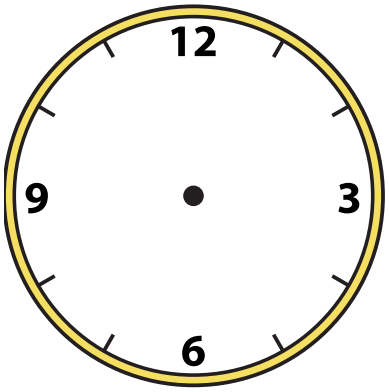

9) 5:10



1-9	89	78	67	56	44	33	22	11	0

Création d'horloges Nom: **Clé**

Dessinez l'aiguille des heures et des minutes sur l'horloge pour qu'elle représente l'heure indiquée.

1) 3:45

2) 3:10



3) 4:40

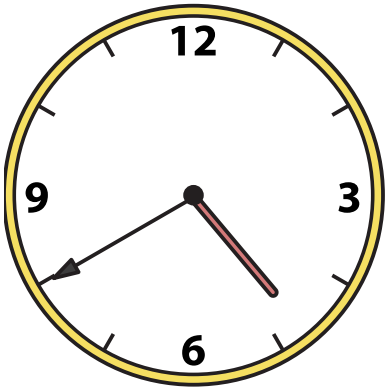

4) 8:30



5) 1:45



6) 9:20

7) 7:20

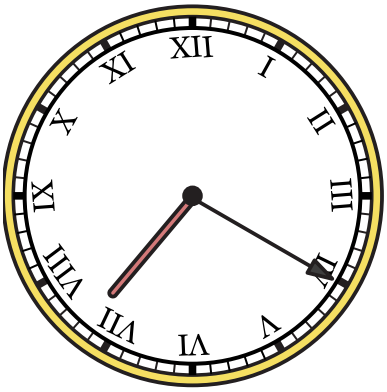

8) 4:55



9) 5:10

1-9	89	78	67	56	44	33	22	11	0