Trouver le temps écoulé avec une ligne numérique

Nom:

Résoudre chaque problème.

1) Start: 2:15

Elapsed: _____

End: 3:55

2) Start: 2:10

Elapsed: _____

End: 4:55

3) Start: 2:45

Elapsed: _____

End: 4:55

4) Start: 2:20

Elapsed: _____

End: 3:40

5) Start: 11:05

Elapsed: _____

End: 1:30

6) Start: 11:05

Elapsed: _____

End: 1:25

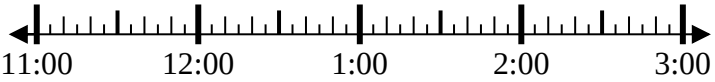

7) Start: 3:45

Elapsed: _____

End: 6:05

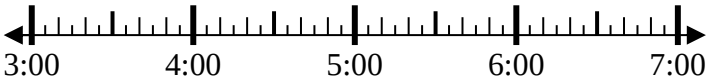

8) Start: 6:20

Elapsed: _____

End: 7:50

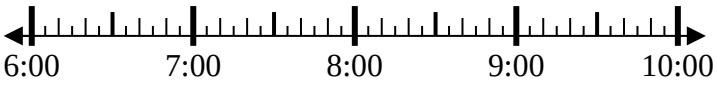

Réponses

1. _____
2. _____
3. _____
4. _____
5. _____
6. _____
7. _____
8. _____

1-8	88	75	63	50	38	25	13	0

Trouver le temps écoulé avec une ligne numérique Nom: **Clé**

Résoudre chaque problème.

1) Start: 2:15
Elapsed: 1 hr et 40 mins
End: 3:55

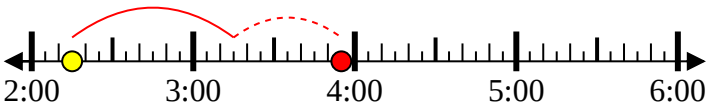

2) Start: 2:10
Elapsed: 2 hrs et 45 mins
End: 4:55

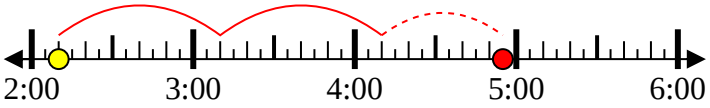

3) Start: 2:45
Elapsed: 2 hrs et 10 mins
End: 4:55

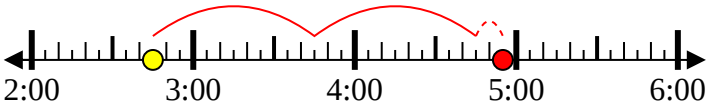

4) Start: 2:20
Elapsed: 1 hr et 20 mins
End: 3:40

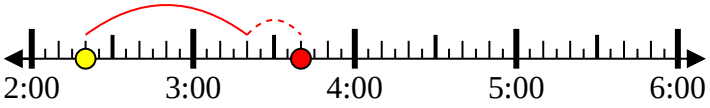

5) Start: 11:05
Elapsed: 2 hrs et 25 mins
End: 1:30

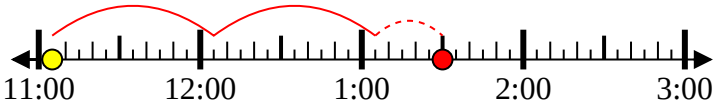

6) Start: 11:05
Elapsed: 2 hrs et 20 mins
End: 1:25

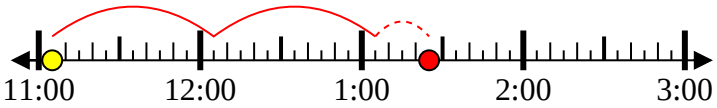

7) Start: 3:45
Elapsed: 2 hrs et 20 mins
End: 6:05

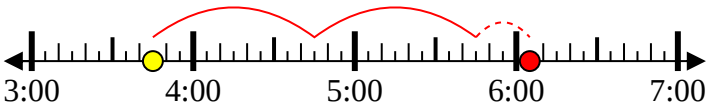

8) Start: 6:20
Elapsed: 1 hr et 30 mins
End: 7:50

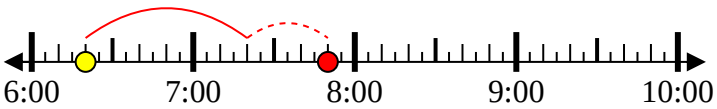

Réponses

1. **1 hr et 40 mins**
2. **2 hrs et 45 mins**
3. **2 hrs et 10 mins**
4. **1 hr et 20 mins**
5. **2 hrs et 25 mins**
6. **2 hrs et 20 mins**
7. **2 hrs et 20 mins**
8. **1 hr et 30 mins**

1-8	88	75	63	50	38	25	13	0