Calculs de Nombre de Blocs par leurs Positions

Nom:

Comptez le nombre total de blocs.

1)
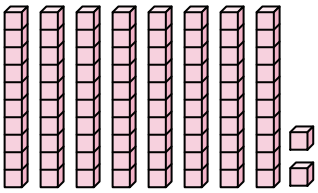

2)
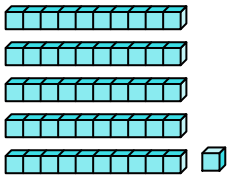

3)
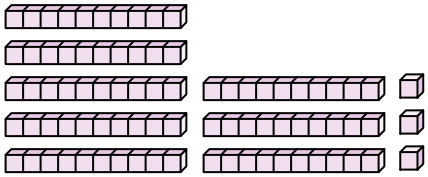

4)
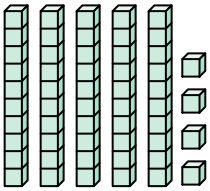

5)
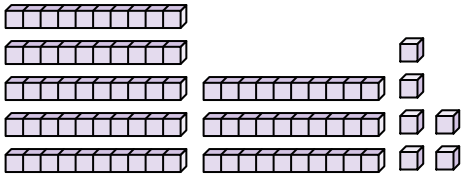

6)
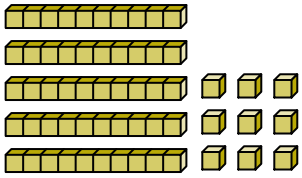

7)
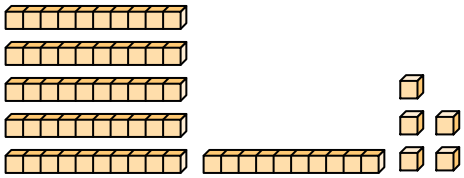

8)
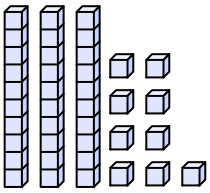

9)
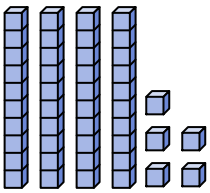

10)
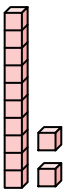

11)
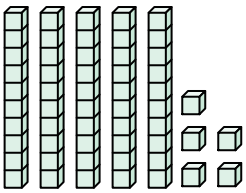

12)
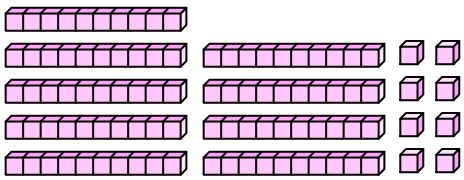

Réponses

1. _____
2. _____
3. _____
4. _____
5. _____
6. _____
7. _____
8. _____
9. _____
10. _____
11. _____
12. _____

1-10	92	83	75	67	58	50	42	33	25	17
11-12	8	0								

Calculs de Nombre de Blocs par leurs Positions Nom: **Clé**

Comptez le nombre total de blocs.

1) 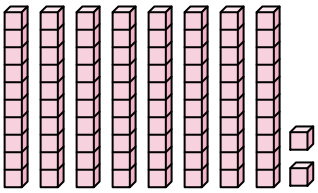

2) 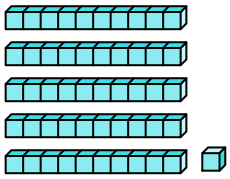

3) 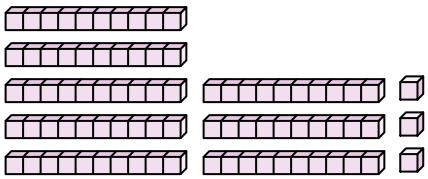

4) 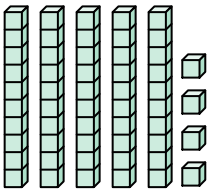

5) 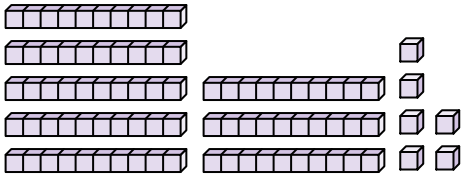

6) 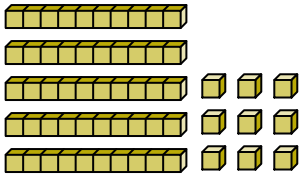

7) 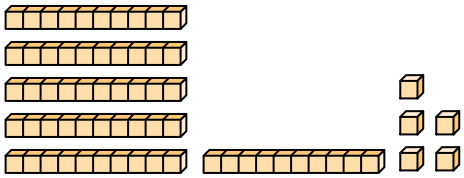

8) 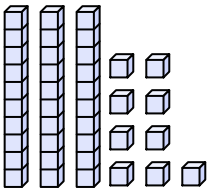

9) 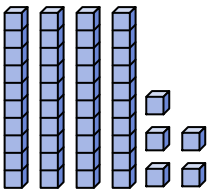

10) 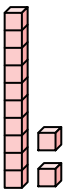

11) 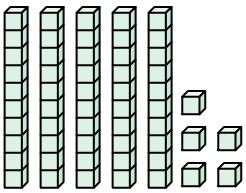

12) 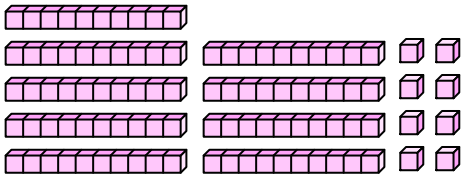

Réponses

1. 82
2. 51
3. 83
4. 54
5. 86
6. 59
7. 65
8. 39
9. 45
10. 12
11. 55
12. 98

1-10	92	83	75	67	58	50	42	33	25	17
11-12	8	0								

Calculs de Nombre de Blocs par leurs Positions

Nom:

Comptez le nombre total de blocs.

51	45	54	39	65
86	59	82	12	83

1)



2)

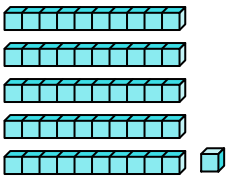

3)

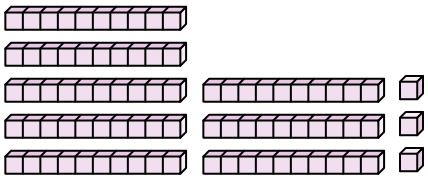

4)

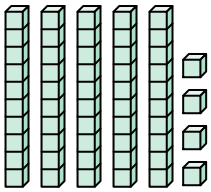

5)

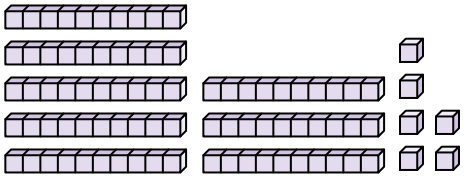

6)

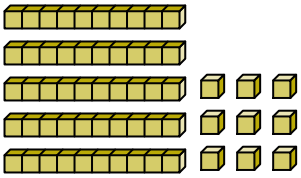

7)

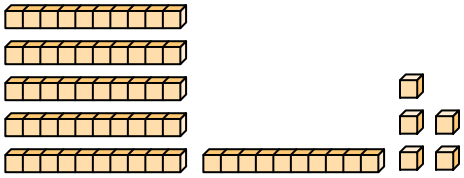

8)

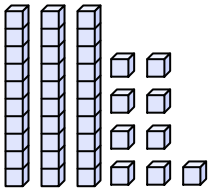

9)

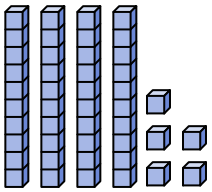

10)

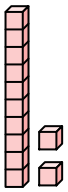

Réponses

1. _____
2. _____
3. _____
4. _____
5. _____
6. _____
7. _____
8. _____
9. _____
10. _____

Calculs de Nombre de Blocs par leurs Positions

Nom:

Comptez le nombre total de blocs.

1)

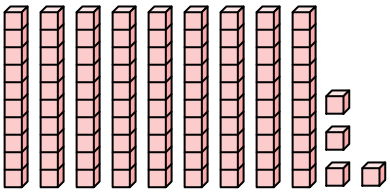

2)

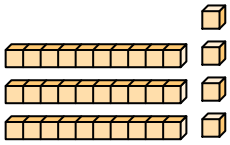

3)

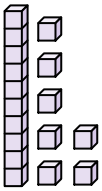

4)

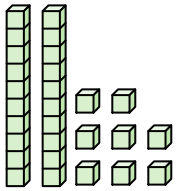

5)

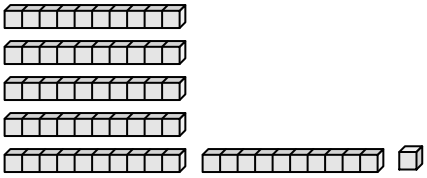

6)

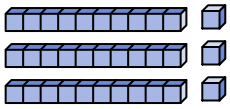

7)

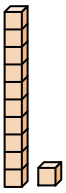

8)

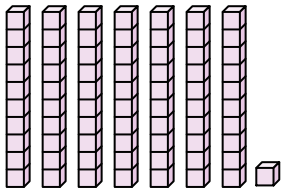

9)

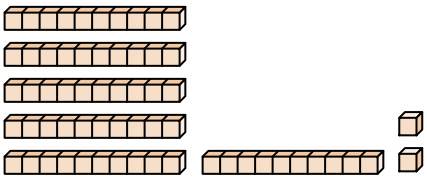

10)

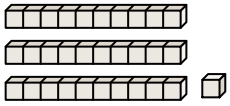

11)

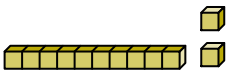

12)

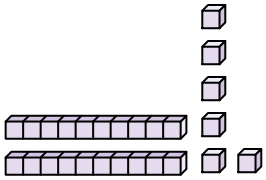

Réponses

1. _____
2. _____
3. _____
4. _____
5. _____
6. _____
7. _____
8. _____
9. _____
10. _____
11. _____
12. _____

1-10	92	83	75	67	58	50	42	33	25	17
11-12	8	0								

Calculs de Nombre de Blocs par leurs Positions Nom: **Clé**

Comptez le nombre total de blocs.

1) 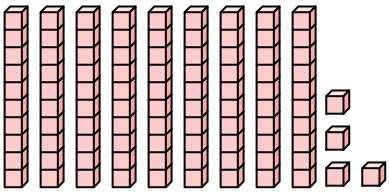

2) 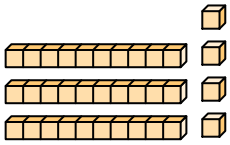

3) 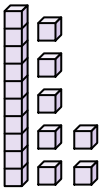

4) 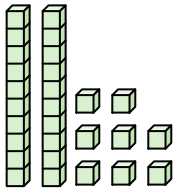

5) 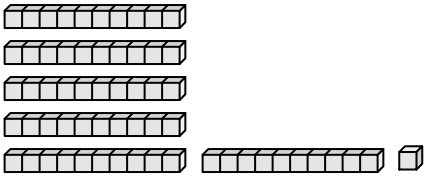

6) 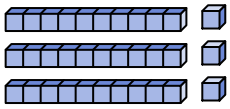

7) 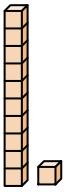

8) 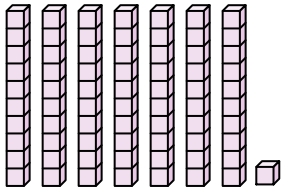

9) 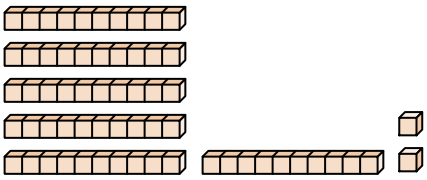

10) 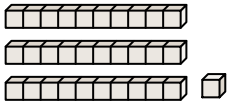

11) 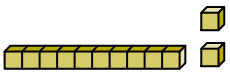

12) 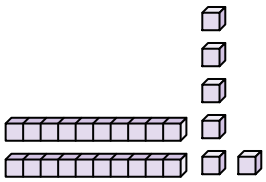

Réponses

1. **94**
2. **34**
3. **17**
4. **28**
5. **61**
6. **33**
7. **11**
8. **71**
9. **62**
10. **31**
11. **12**
12. **26**

1-10	92	83	75	67	58	50	42	33	25	17
11-12	8	0								

Calculs de Nombre de Blocs par leurs Positions

Nom:

Comptez le nombre total de blocs.

62	11	33	31	61
71	28	17	34	94

1)

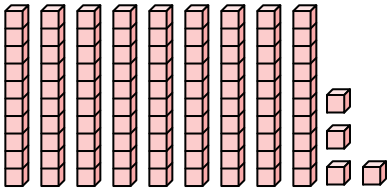

2)

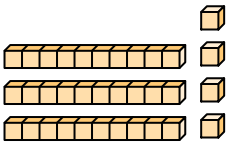

3)

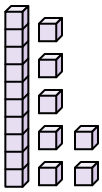

4)

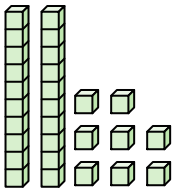

5)

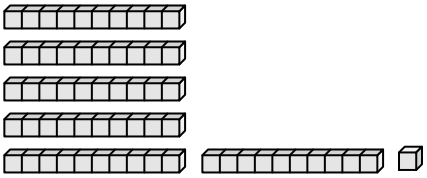

6)

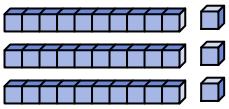

7)

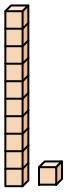

8)

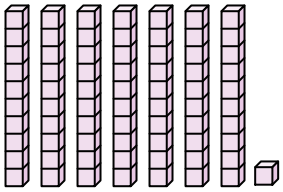

9)

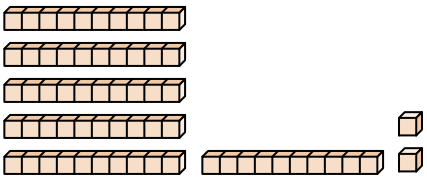

10)

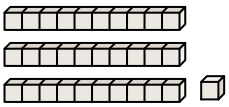

Réponses

1. _____
2. _____
3. _____
4. _____
5. _____
6. _____
7. _____
8. _____
9. _____
10. _____

1-10	90	80	70	60	50	40	30	20	10	0

Calculs de Nombre de Blocs par leurs Positions

Nom:

Comptez le nombre total de blocs.

1)

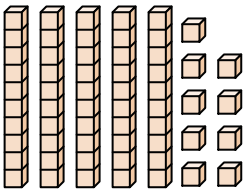

2)

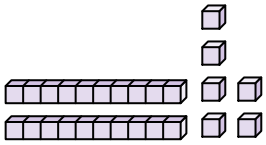

3)

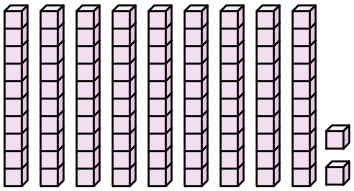

4)

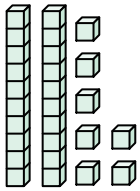

5)

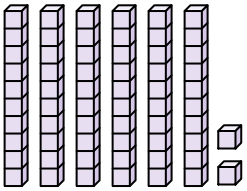

6)

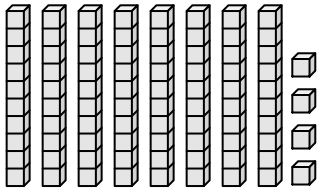

7)

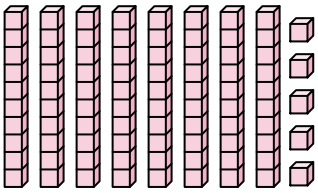

8)

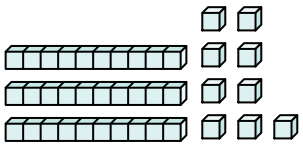

9)

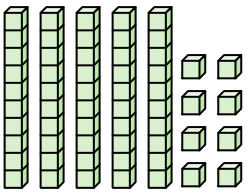

10)

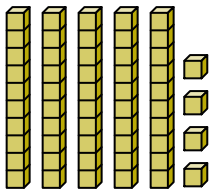

11)

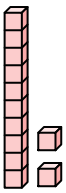

12)

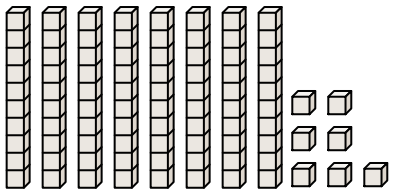

Réponses

1. _____
2. _____
3. _____
4. _____
5. _____
6. _____
7. _____
8. _____
9. _____
10. _____
11. _____
12. _____

1-10	92	83	75	67	58	50	42	33	25	17
11-12	8	0								

Calculs de Nombre de Blocs par leurs Positions Nom: **Clé**

Comptez le nombre total de blocs.

1) 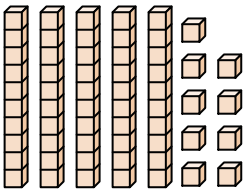

2) 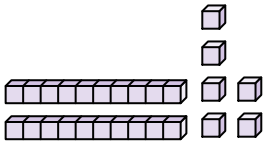

3) 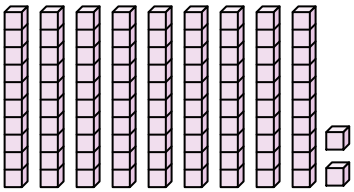

4) 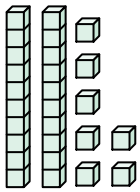

5) 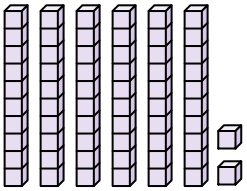

6) 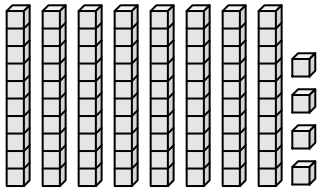

7) 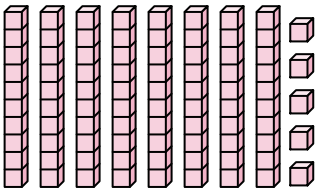

8) 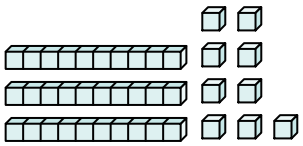

9) 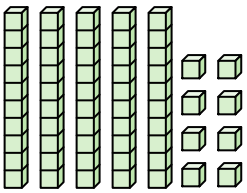

10) 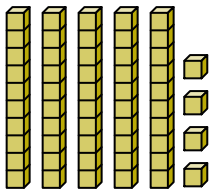

11) 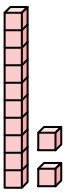

12) 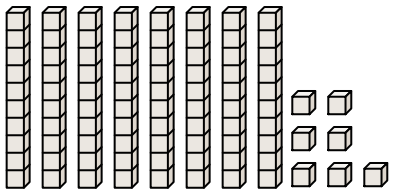

Réponses

1. 59
2. 26
3. 92
4. 27
5. 62
6. 84
7. 85
8. 39
9. 58
10. 54
11. 12
12. 87

1-10	92	83	75	67	58	50	42	33	25	17
11-12	8	0								

Calculs de Nombre de Blocs par leurs Positions Nom:

Comptez le nombre total de blocs.

62	54	58	27	84
59	85	26	92	39

1)

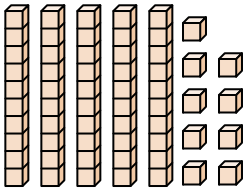

2)

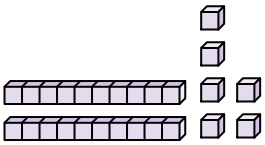

3)

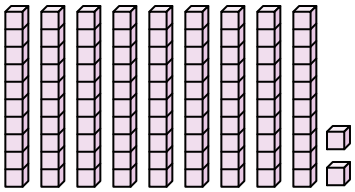

4)

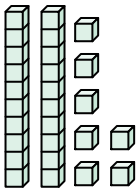

5)

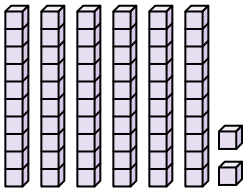

6)

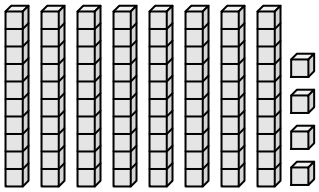

7)



8)

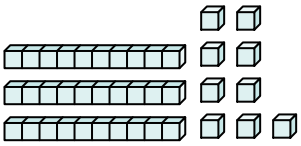

9)

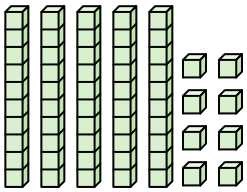

10)

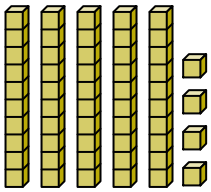

Réponses

1. _____
2. _____
3. _____
4. _____
5. _____
6. _____
7. _____
8. _____
9. _____
10. _____

1-10	90	80	70	60	50	40	30	20	10	0

Calculs de Nombre de Blocs par leurs Positions

Nom:

Comptez le nombre total de blocs.

1)

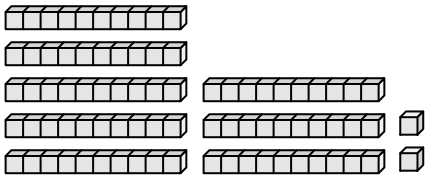

2)

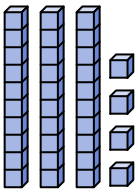

3)

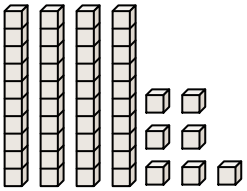

4)

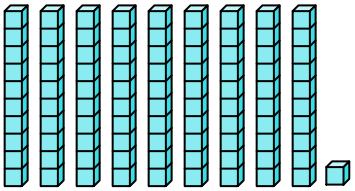

5)

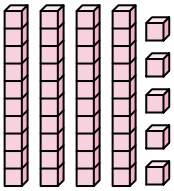

6)

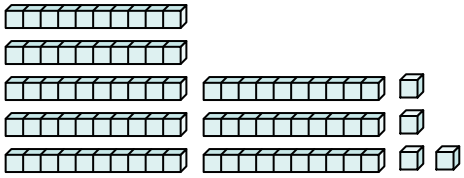

7)

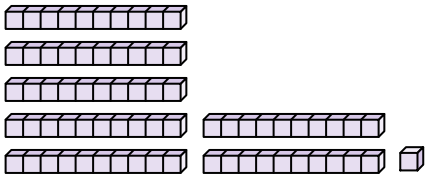

8)

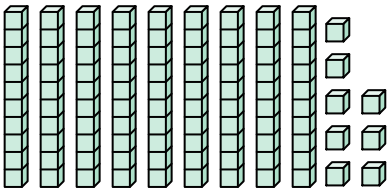

9)

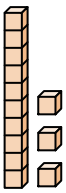

10)

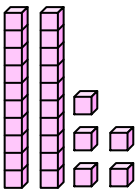

11)

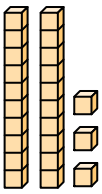

12)

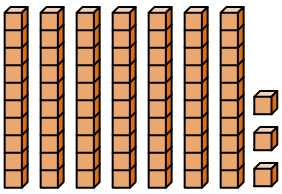

Réponses

1. _____
2. _____
3. _____
4. _____
5. _____
6. _____
7. _____
8. _____
9. _____
10. _____
11. _____
12. _____

1-10	92	83	75	67	58	50	42	33	25	17
11-12	8	0								

Calculs de Nombre de Blocs par leurs Positions Nom: **Clé**

Comptez le nombre total de blocs.

1) 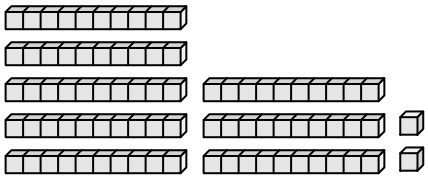

2) 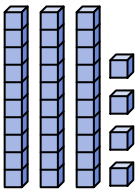

3) 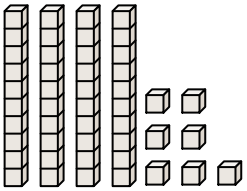

4) 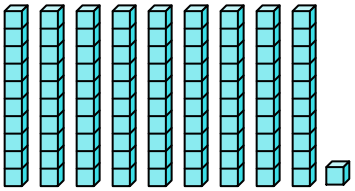

5) 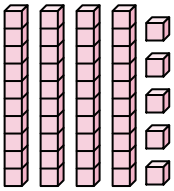

6) 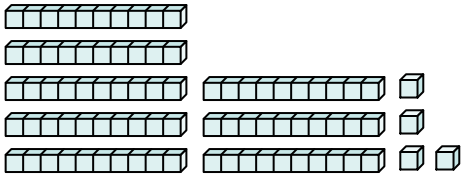

7) 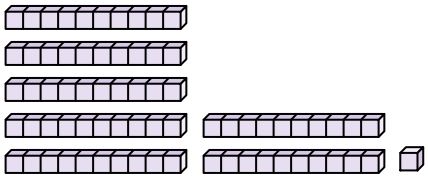

8) 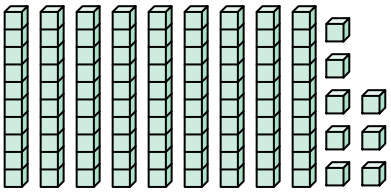

9) 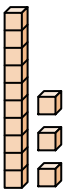

10) 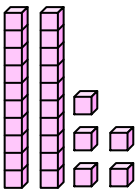

11) 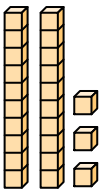

12) 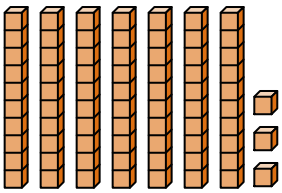

Réponses

1. 82
2. 34
3. 47
4. 91
5. 45
6. 84
7. 71
8. 98
9. 13
10. 25
11. 23
12. 73

1-10	92	83	75	67	58	50	42	33	25	17
11-12	8	0								

Calculs de Nombre de Blocs par leurs Positions Nom:

Comptez le nombre total de blocs.

45	71	98	84	47
34	91	13	25	82

1)

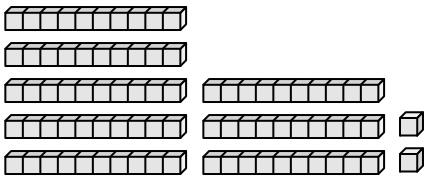

2)

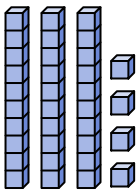

3)

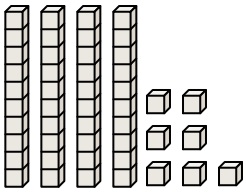

4)

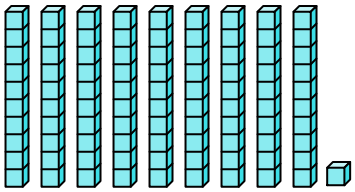

5)

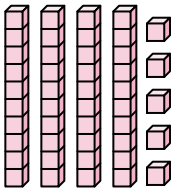

6)

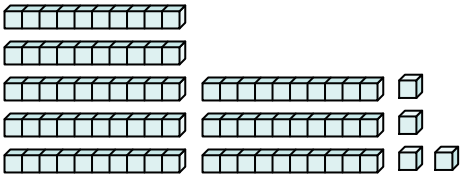

7)

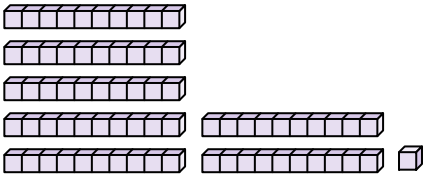

8)

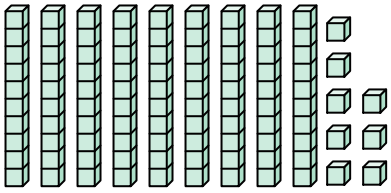

9)

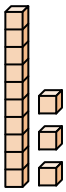

10)

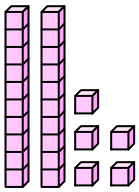

Réponses

1. _____
2. _____
3. _____
4. _____
5. _____
6. _____
7. _____
8. _____
9. _____
10. _____

1-10	90	80	70	60	50	40	30	20	10	0

Calculs de Nombre de Blocs par leurs Positions

Nom:

Comptez le nombre total de blocs.

1)

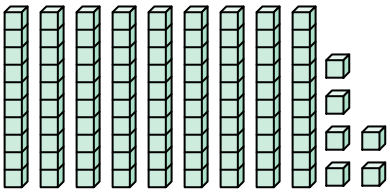

2)

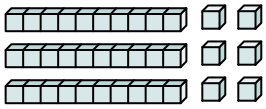

3)

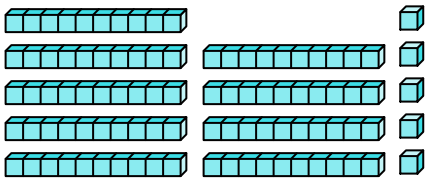

4)

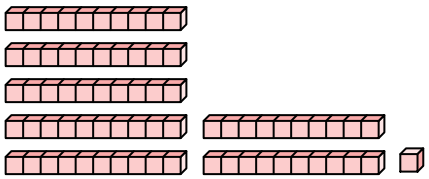

5)

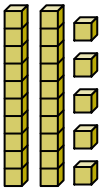

6)

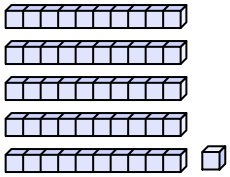

7)

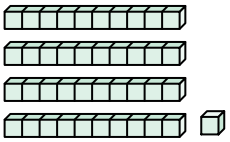

8)

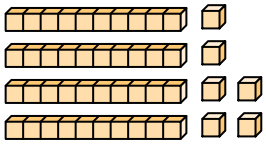

9)

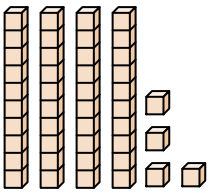

10)

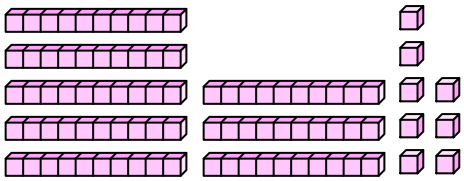

11)

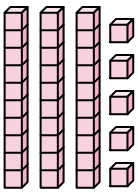

12)

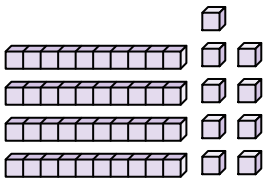

Réponses

1. _____
2. _____
3. _____
4. _____
5. _____
6. _____
7. _____
8. _____
9. _____
10. _____
11. _____
12. _____

1-10	92	83	75	67	58	50	42	33	25	17
11-12	8	0								

Calculs de Nombre de Blocs par leurs Positions Nom: **Clé**

Comptez le nombre total de blocs.

1) 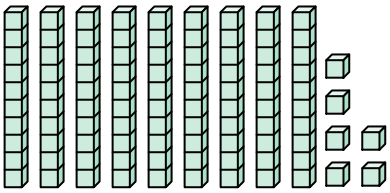

2) 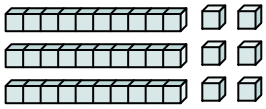

3) 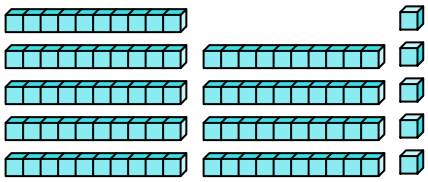

4) 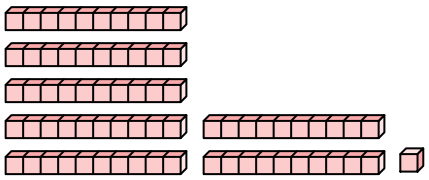

5) 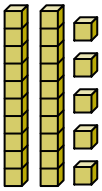

6) 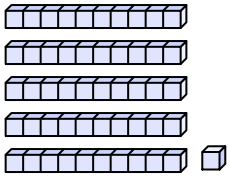

7) 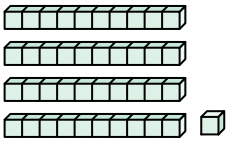

8) 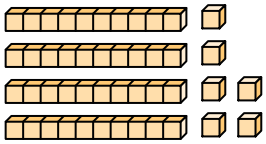

9) 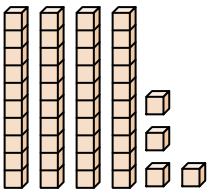

10) 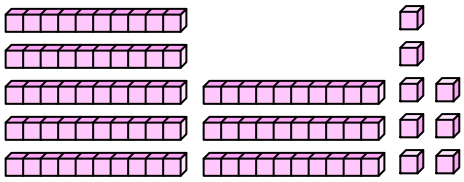

11) 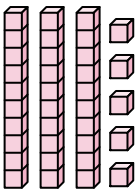

12) 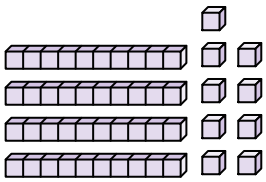

Réponses

1. **96**
2. **36**
3. **95**
4. **71**
5. **25**
6. **51**
7. **41**
8. **46**
9. **44**
10. **88**
11. **35**
12. **49**

1-10	92	83	75	67	58	50	42	33	25	17
11-12	8	0								

Calculs de Nombre de Blocs par leurs Positions

Nom:

Comptez le nombre total de blocs.

88	25	36	44	46
41	51	96	71	95

1)

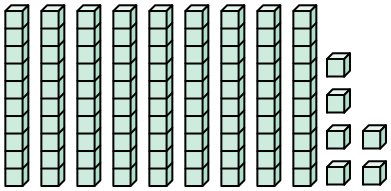

2)

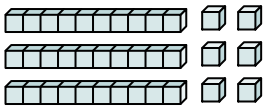

3)

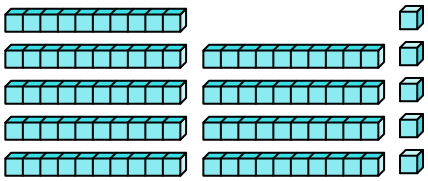

4)

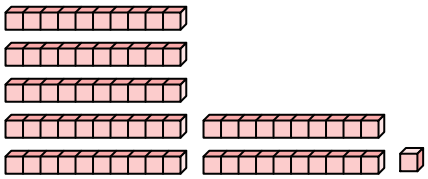

5)

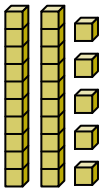

6)

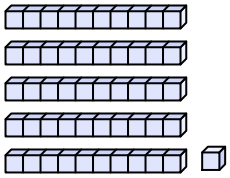

7)

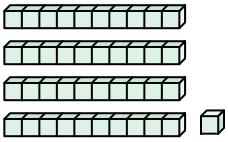

8)

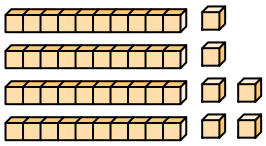

9)

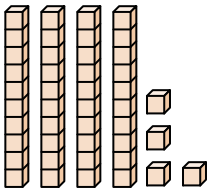

10)

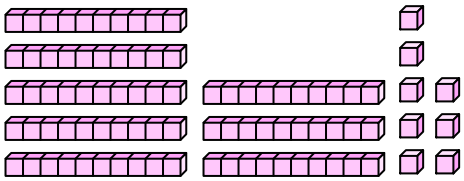

Réponses

1. _____
2. _____
3. _____
4. _____
5. _____
6. _____
7. _____
8. _____
9. _____
10. _____

1-10	90	80	70	60	50	40	30	20	10	0

Calculs de Nombre de Blocs par leurs Positions

Nom:

Comptez le nombre total de blocs.

1)

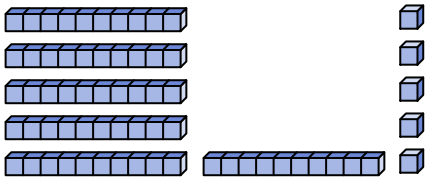

2)

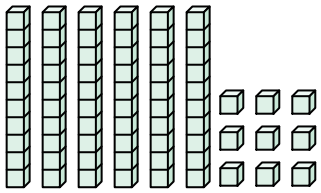

3)

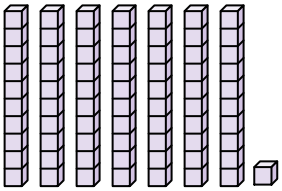

4)

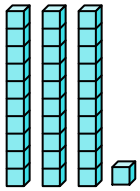

5)

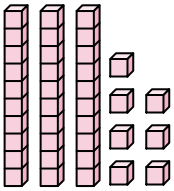

6)

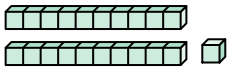

7)

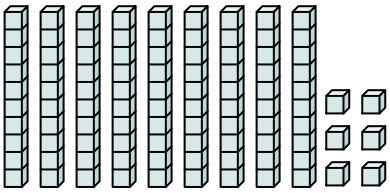

8)

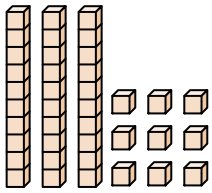

9)

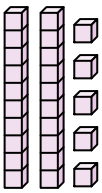

10)

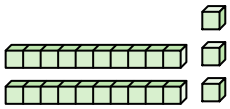

11)

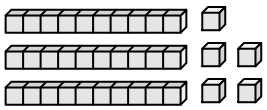

12)

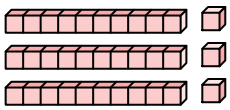

Réponses

1. _____
2. _____
3. _____
4. _____
5. _____
6. _____
7. _____
8. _____
9. _____
10. _____
11. _____
12. _____

1-10	92	83	75	67	58	50	42	33	25	17
11-12	8	0								

Calculs de Nombre de Blocs par leurs Positions Nom: **Clé**

Comptez le nombre total de blocs.

1)
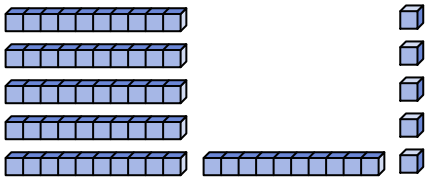

2)
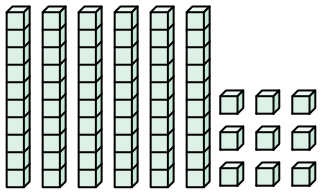

3)
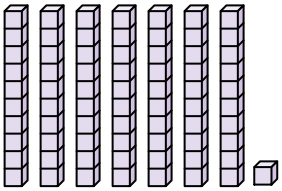

4)
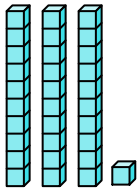

5)
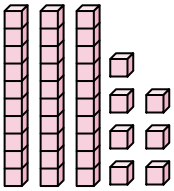

6)
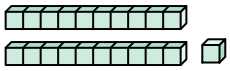

7)
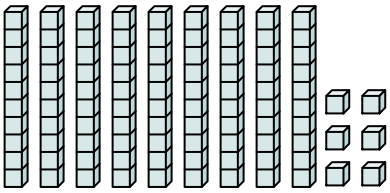

8)
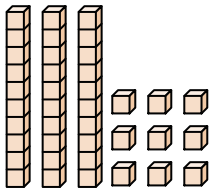

9)
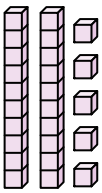

10)
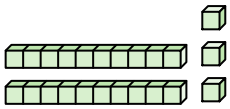

11)
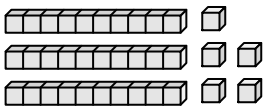

12)
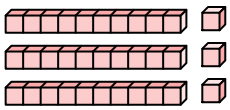

Réponses

1. 65
2. 69
3. 71
4. 31
5. 37
6. 21
7. 96
8. 39
9. 25
10. 23
11. 35
12. 33

1-10	92	83	75	67	58	50	42	33	25	17
11-12	8	0								

Calculs de Nombre de Blocs par leurs Positions Nom:

Comptez le nombre total de blocs.

23	71	65	31	69
96	21	37	39	25

1)

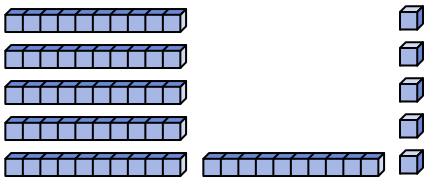

2)

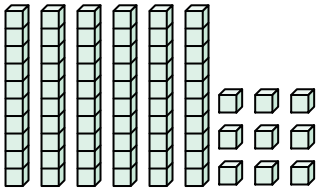

3)

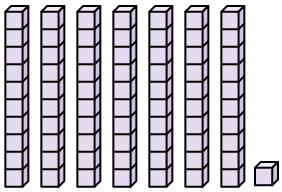

4)

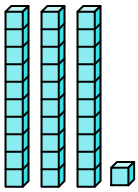

5)

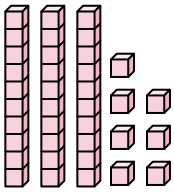

6)

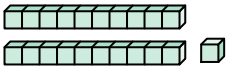

7)

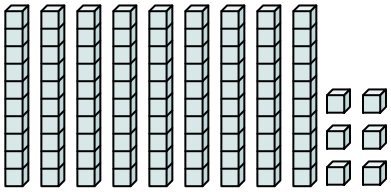

8)

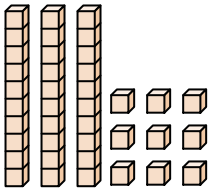

9)

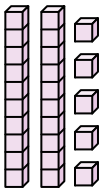

10)

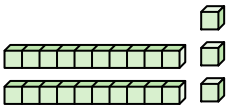

Réponses

1. _____
2. _____
3. _____
4. _____
5. _____
6. _____
7. _____
8. _____
9. _____
10. _____

1-10	90	80	70	60	50	40	30	20	10	0

Calculs de Nombre de Blocs par leurs Positions

Nom:

Comptez le nombre total de blocs.

1)

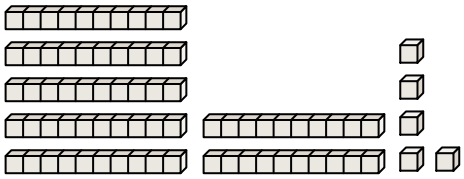

2)

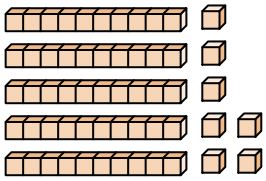

3)

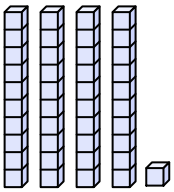

4)

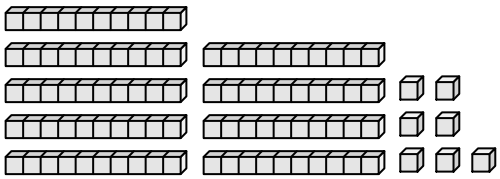

5)



6)

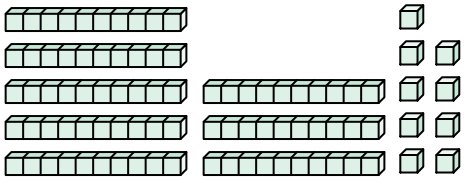

7)

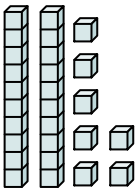

8)

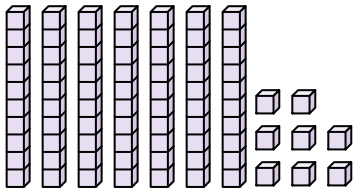

9)

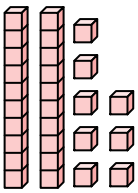

10)

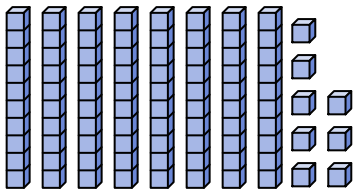

11)

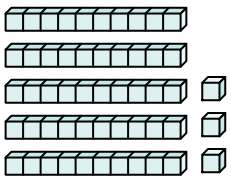

12)

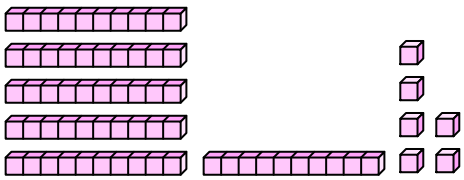

Réponses

1. _____
2. _____
3. _____
4. _____
5. _____
6. _____
7. _____
8. _____
9. _____
10. _____
11. _____
12. _____

1-10	92	83	75	67	58	50	42	33	25	17
11-12	8	0								

Calculs de Nombre de Blocs par leurs Positions Nom: **Clé**

Comptez le nombre total de blocs.

1) 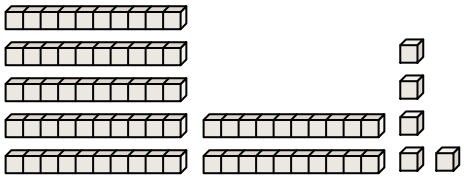

2) 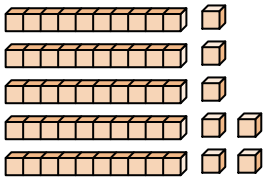

3) 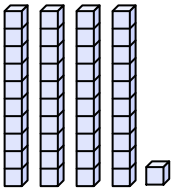

4) 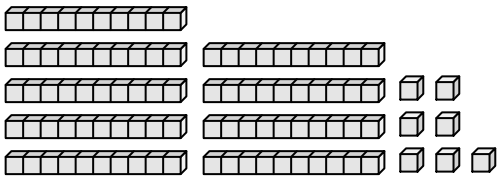

5) 

6) 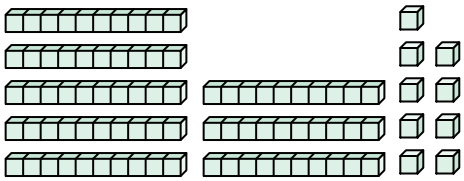

7) 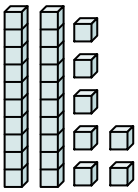

8) 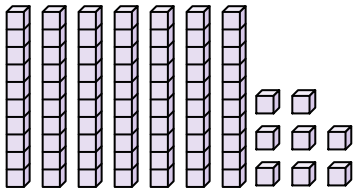

9) 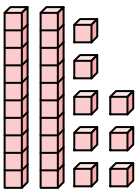

10) 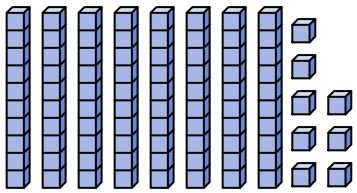

11) 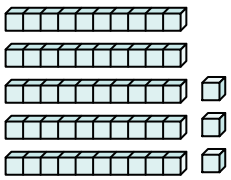

12) 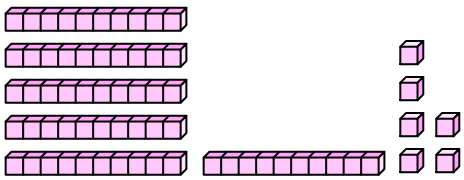

Réponses

1. 75
2. 57
3. 41
4. 97
5. 71
6. 89
7. 27
8. 78
9. 28
10. 88
11. 53
12. 66

1-10	92	83	75	67	58	50	42	33	25	17
11-12	8	0								

Calculs de Nombre de Blocs par leurs Positions Nom:

Comptez le nombre total de blocs.

27	88	57	41	71
78	97	89	28	75

1)

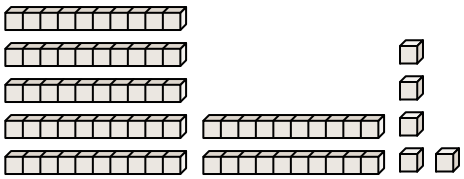

2)

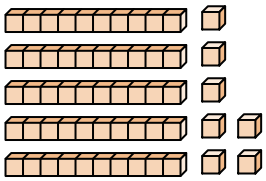

3)

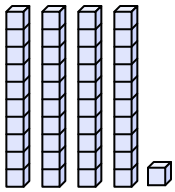

4)

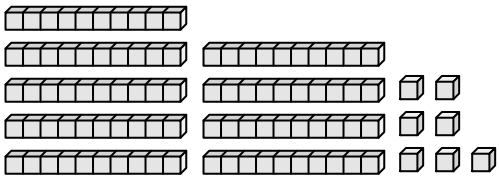

5)



6)

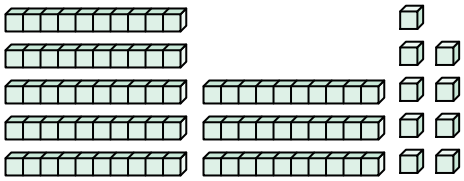

7)

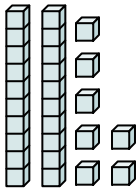

8)

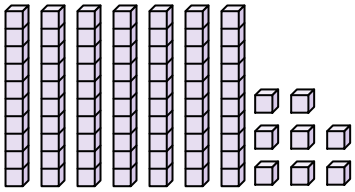

9)

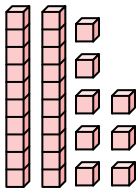

10)

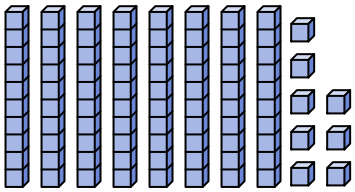

Réponses

1. _____
2. _____
3. _____
4. _____
5. _____
6. _____
7. _____
8. _____
9. _____
10. _____

Calculs de Nombre de Blocs par leurs Positions

Nom:

Comptez le nombre total de blocs.

1) 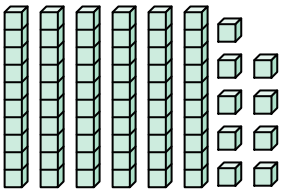

2) 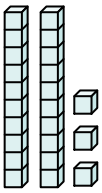

3) 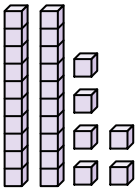

4) 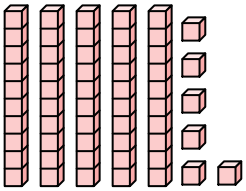

5) 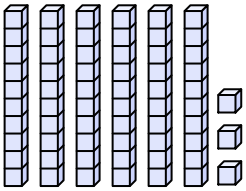

6) 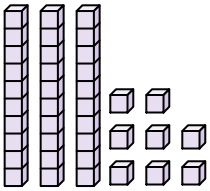

7) 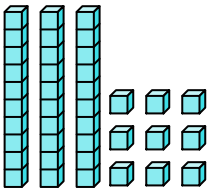

8) 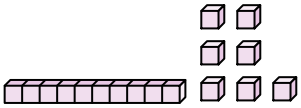

9) 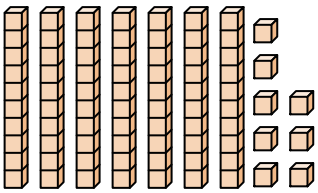

10) 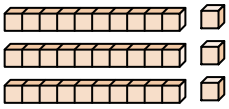

11) 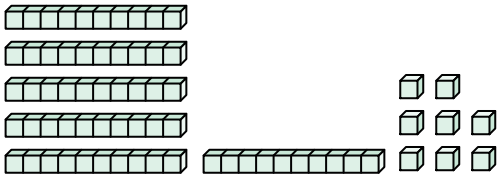

12) 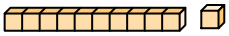

Réponses

1. _____
2. _____
3. _____
4. _____
5. _____
6. _____
7. _____
8. _____
9. _____
10. _____
11. _____
12. _____

1-10	92	83	75	67	58	50	42	33	25	17
11-12	8	0								

Calculs de Nombre de Blocs par leurs Positions Nom: **Clé**

Comptez le nombre total de blocs.

1) 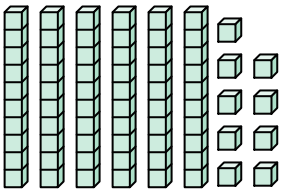

2) 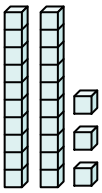

3) 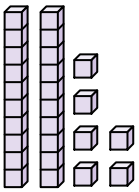

4) 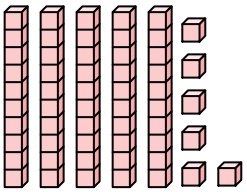

5) 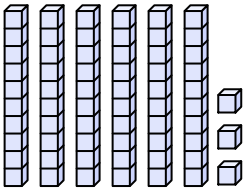

6) 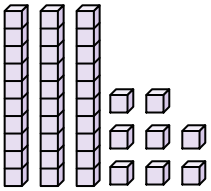

7) 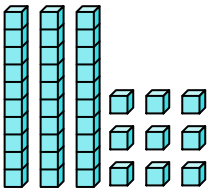

8) 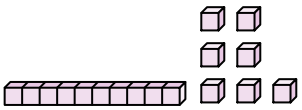

9) 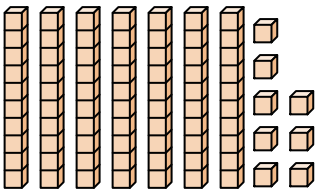

10) 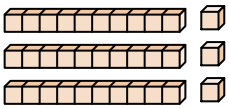

11) 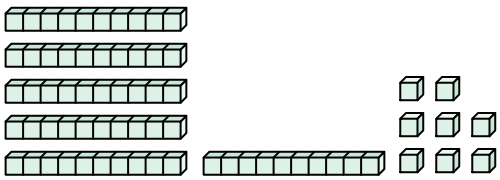

12) 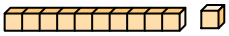

Réponses

1. **69**
2. **23**
3. **26**
4. **56**
5. **63**
6. **38**
7. **39**
8. **17**
9. **78**
10. **33**
11. **68**
12. **11**

1-10	92	83	75	67	58	50	42	33	25	17
11-12	8	0								

Calculs de Nombre de Blocs par leurs Positions

Nom:

Comptez le nombre total de blocs.

23	26	39	17	69
63	56	78	38	33

1)

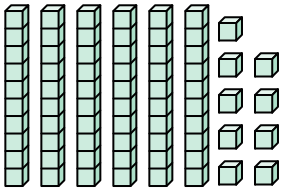

2)

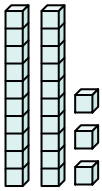

3)

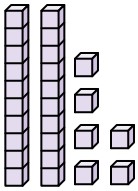

4)

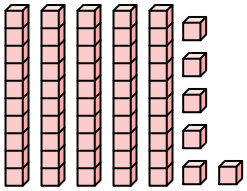

5)

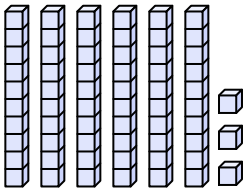

6)

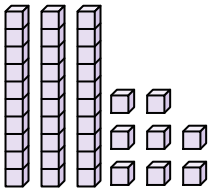

7)

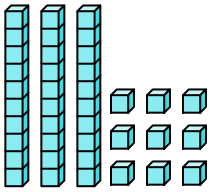

8)

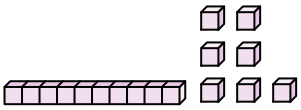

9)

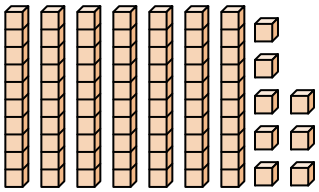

10)

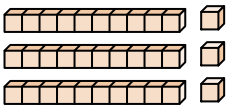

Réponses

1. _____
2. _____
3. _____
4. _____
5. _____
6. _____
7. _____
8. _____
9. _____
10. _____

1-10	90	80	70	60	50	40	30	20	10	0

Calculs de Nombre de Blocs par leurs Positions

Nom:

Comptez le nombre total de blocs.

1)

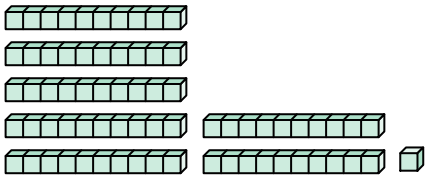

2)

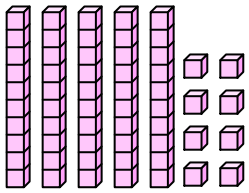

3)

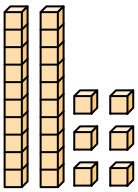

4)

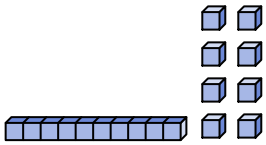

5)

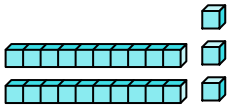

6)

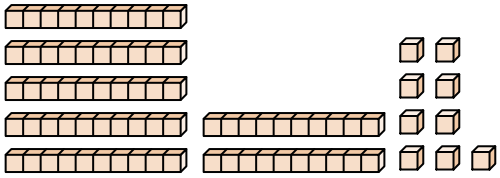

7)

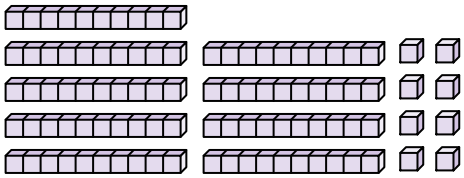

8)

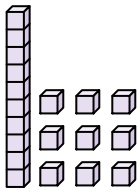

9)

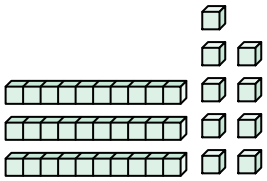

10)

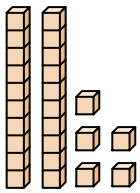

11)

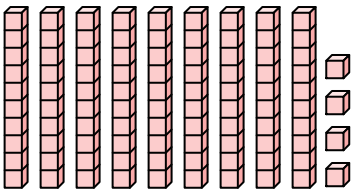

12)

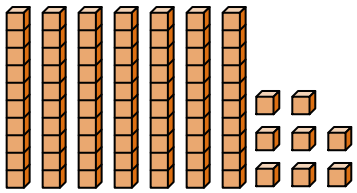

Réponses

1. _____
2. _____
3. _____
4. _____
5. _____
6. _____
7. _____
8. _____
9. _____
10. _____
11. _____
12. _____

1-10	92	83	75	67	58	50	42	33	25	17
11-12	8	0								

Calculs de Nombre de Blocs par leurs Positions Nom: **Clé**

Comptez le nombre total de blocs.

1) 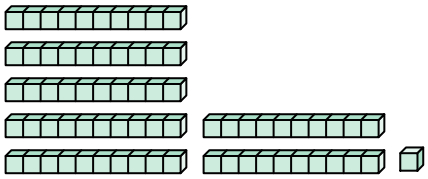

2) 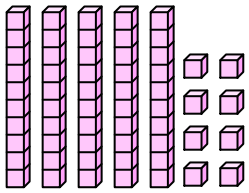

3) 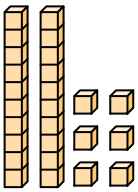

4) 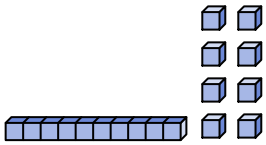

5) 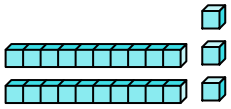

6) 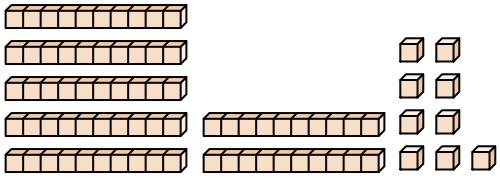

7) 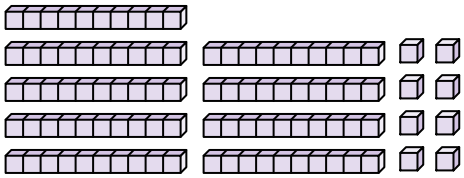

8) 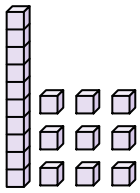

9) 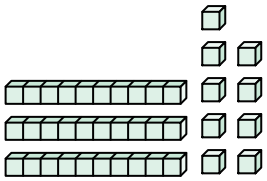

10) 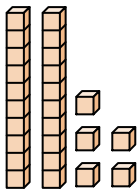

11) 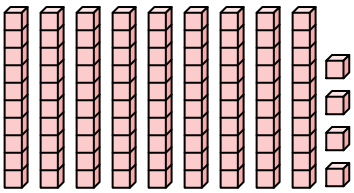

12) 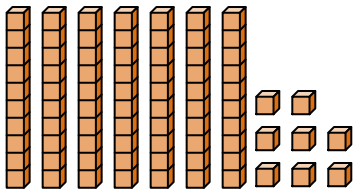

Réponses

1. 71
2. 58
3. 26
4. 18
5. 23
6. 79
7. 98
8. 19
9. 39
10. 25
11. 94
12. 78

1-10	92	83	75	67	58	50	42	33	25	17
11-12	8	0								

Calculs de Nombre de Blocs par leurs Positions Nom:

Comptez le nombre total de blocs.

19	26	79	58	23
98	39	25	71	18

1)

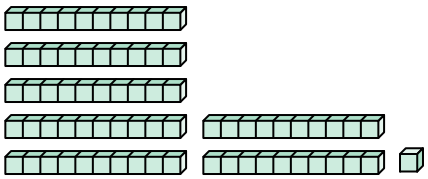

2)

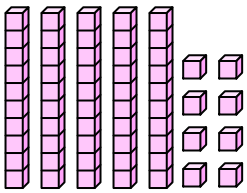

3)

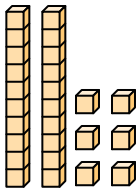

4)

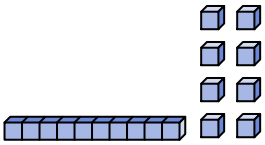

5)

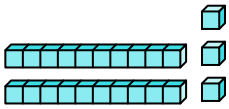

6)

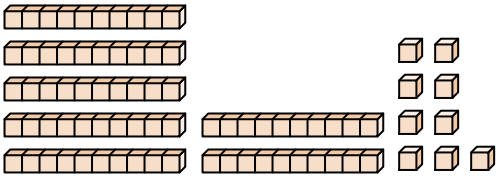

7)

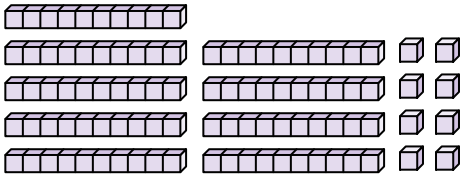

8)

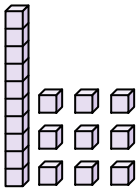

9)

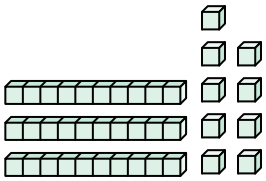

10)

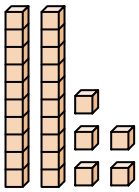

Réponses

1. _____
2. _____
3. _____
4. _____
5. _____
6. _____
7. _____
8. _____
9. _____
10. _____

1-10	90	80	70	60	50	40	30	20	10	0

Calculs de Nombre de Blocs par leurs Positions

Nom:

Comptez le nombre total de blocs.

1) 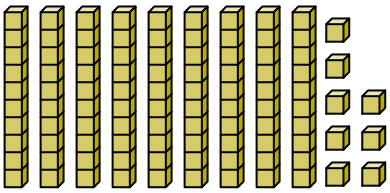

2) 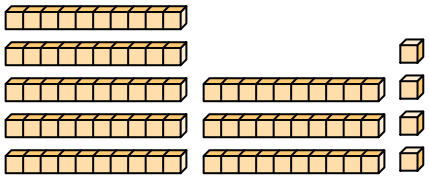

3) 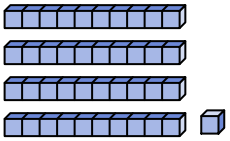

4) 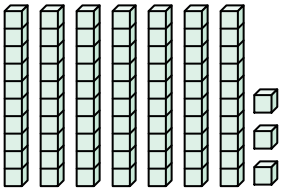

5) 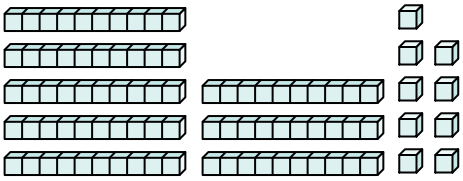

6) 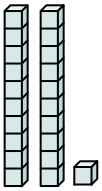

7) 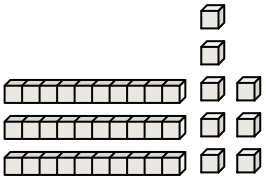

8) 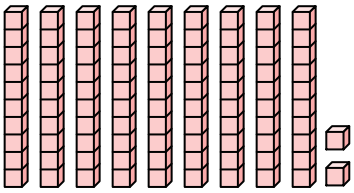

9) 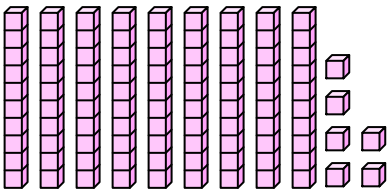

10) 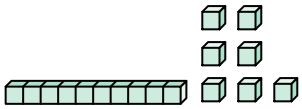

11) 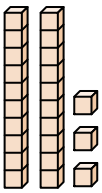

12) 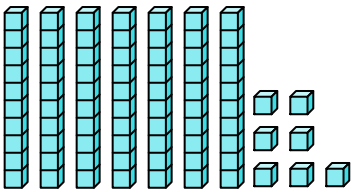

Réponses

1. _____
2. _____
3. _____
4. _____
5. _____
6. _____
7. _____
8. _____
9. _____
10. _____
11. _____
12. _____

1-10	92	83	75	67	58	50	42	33	25	17
11-12	8	0								

Calculs de Nombre de Blocs par leurs Positions Nom: **Clé**

Comptez le nombre total de blocs.

1) 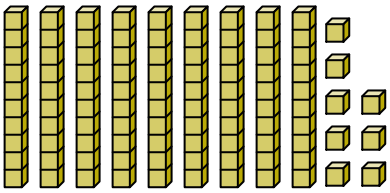

2) 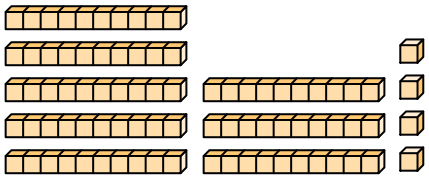

3) 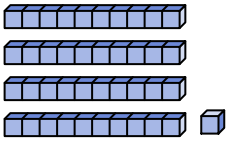

4) 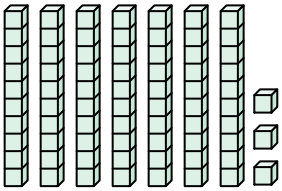

5) 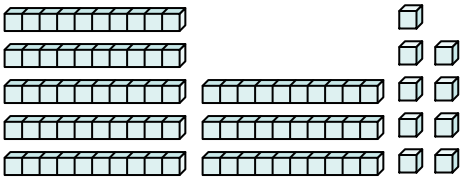

6) 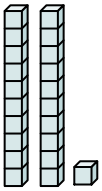

7) 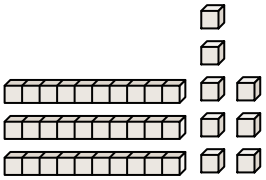

8) 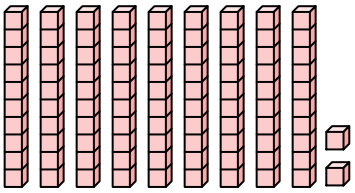

9) 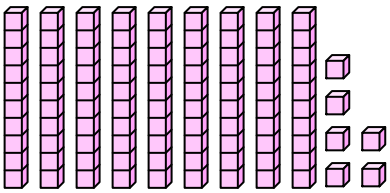

10) 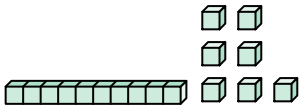

11) 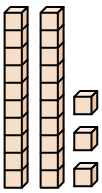

12) 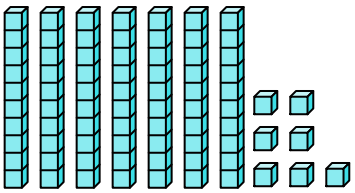

Réponses

1. 98
2. 84
3. 41
4. 73
5. 89
6. 21
7. 38
8. 92
9. 96
10. 17
11. 23
12. 77

1-10	92	83	75	67	58	50	42	33	25	17
11-12	8	0								

Calculs de Nombre de Blocs par leurs Positions Nom:

Comptez le nombre total de blocs.

38	96	98	92	21
41	89	84	73	17

1)

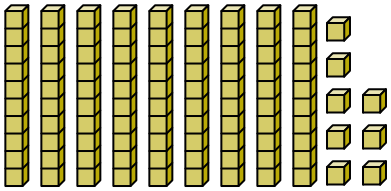

2)

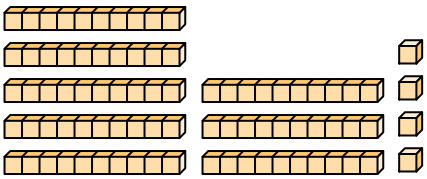

3)

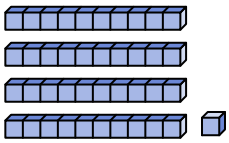

4)

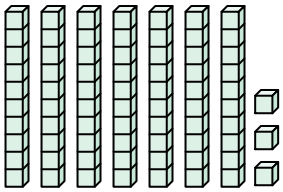

5)

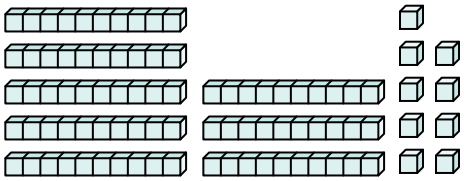

6)

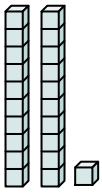

7)

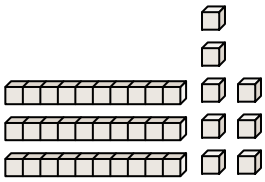

8)

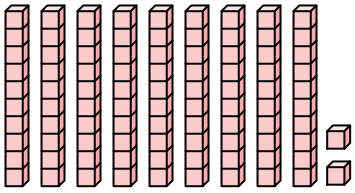

9)

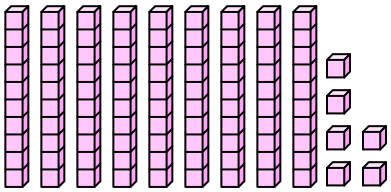

10)

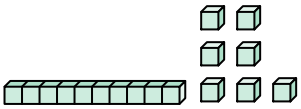

Réponses

1. _____
2. _____
3. _____
4. _____
5. _____
6. _____
7. _____
8. _____
9. _____
10. _____

1-10	90	80	70	60	50	40	30	20	10	0