Compléter les Droites Numériques Nom:

**Remplissez les blancs sur une droite numérique. Les incréments sont de 1.**

**1)**

**2)**




**3)**




**4)**

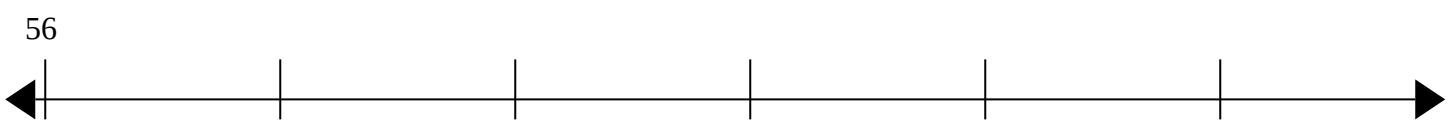


**5)**




**6)**




**7)**

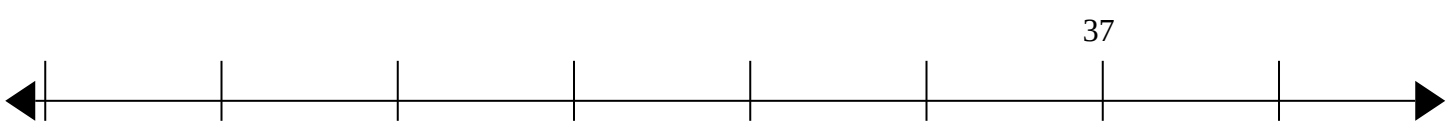


**8)**

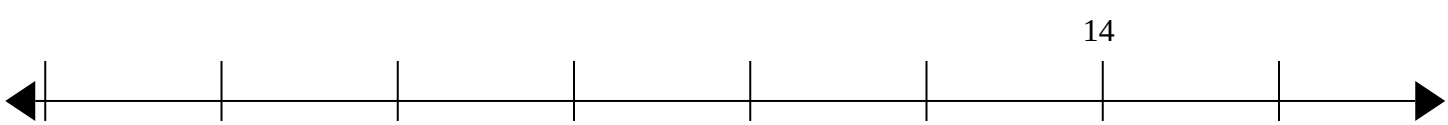


**9)**

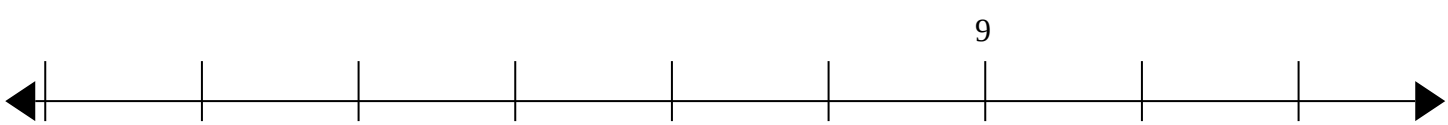


**10)**






| 1-10 | 90 | 80 | 70 | 60 | 50 | 40 | 30 | 20 | 10 | 0 |
|---|---|---|---|---|---|---|---|---|---|---|

Compléter les Droites Numériques Nom: **Clé**

**Remplissez les blancs sur une droite numérique. Les incréments sont de 1.**

**1)** 18 19 20 21 22 23 24 25

**2)** 60 61 62 63 64

**3)** 33 34 35 36 37

**4)** 56 57 58 59 60 61

**5)** 49 50 51 52 53

**6)** 31 32 33 34 35 36 37

**7)** 31 32 33 34 35 36 37 38

**8)** 8 9 10 11 12 13 14 15

**9)** 3 4 5 6 7 8 9 10 11

**10)** 20 21 22 23 24



| 1-10 | 90 | 80 | 70 | 60 | 50 | 40 | 30 | 20 | 10 | 0 |
|---|---|---|---|---|---|---|---|---|---|---|