Trouver de la valeur avec le bloc de valeur de position (à moins de 1 000) Nom:

Comptez le nombre total de petits blocs.

1)

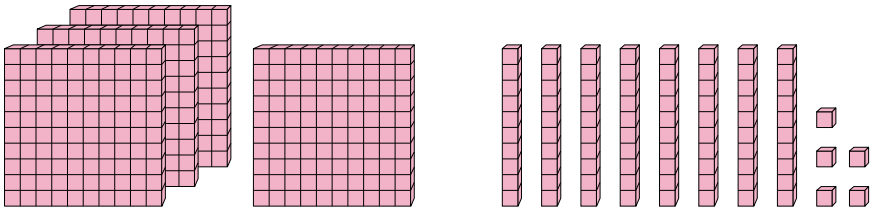

2)

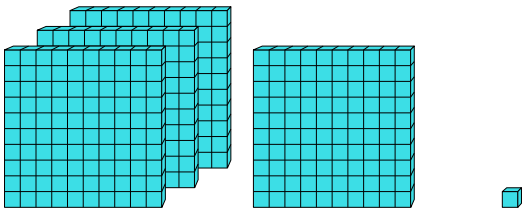

3)

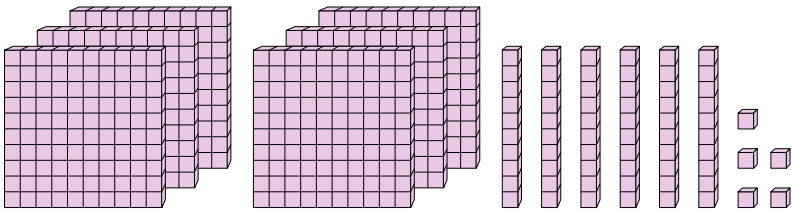

4)

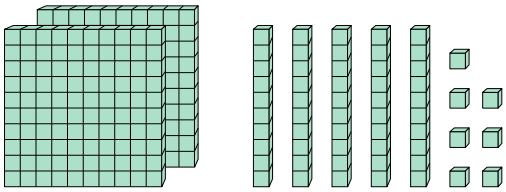

5)

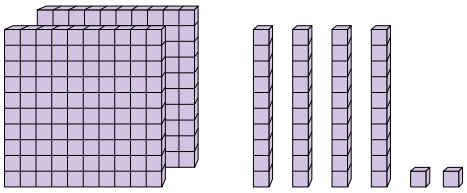

6)

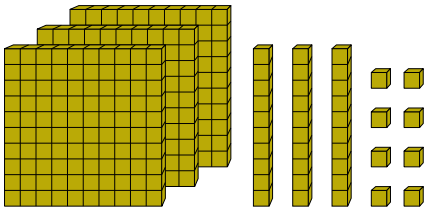

7)

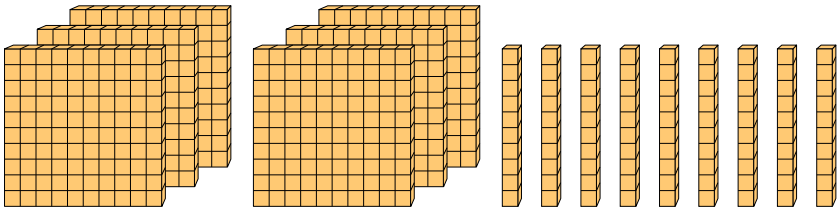

8)

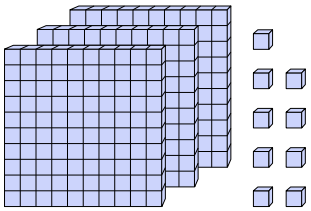

Réponses

1. _____
2. _____
3. _____
4. _____
5. _____
6. _____
7. _____
8. _____

1-8	88	75	63	50	38	25	13	0

Trouver de la valeur avec le bloc de valeur de position (à moins de 1 000) Nom: **Clé**

Comptez le nombre total de petits blocs.

1)

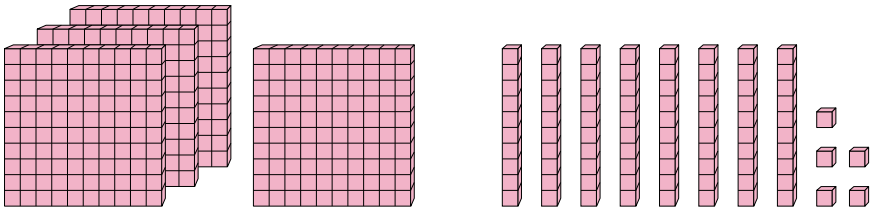

2)

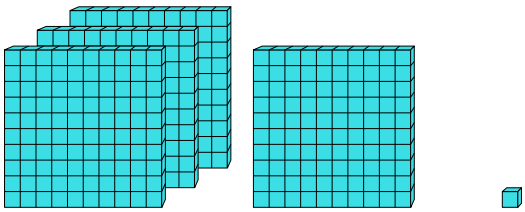

3)

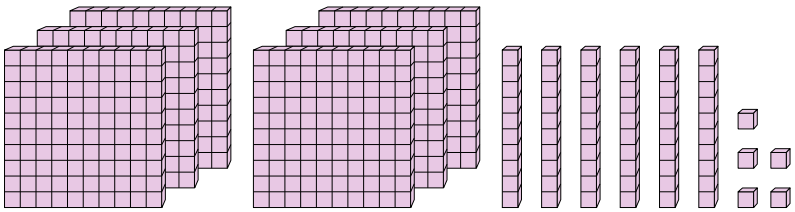

4)

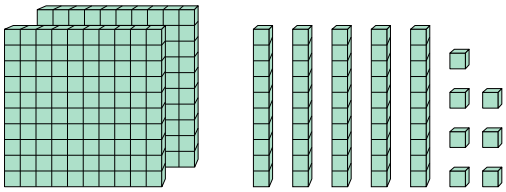

5)

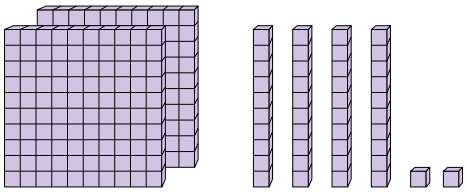

6)

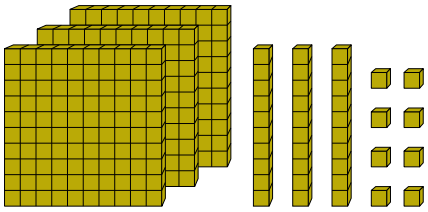

7)

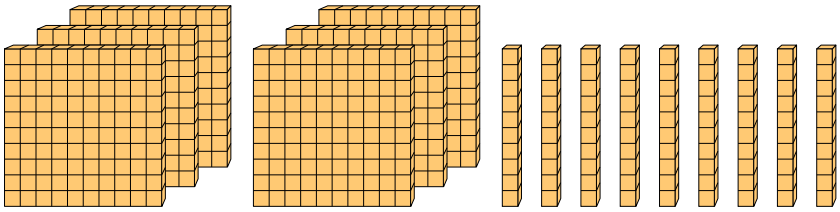

8)

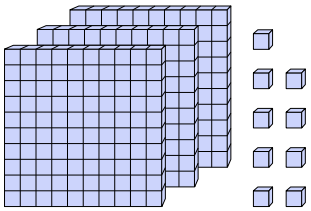

Réponses

1. **485**
2. **401**
3. **665**
4. **257**
5. **242**
6. **338**
7. **690**
8. **309**

1-8	88	75	63	50	38	25	13	0