Ecrire des Inégalités à partir d'une Droite Numérique

Nom:

Ecrivez une inégalité à partir d'une droite numérique.

Ex)

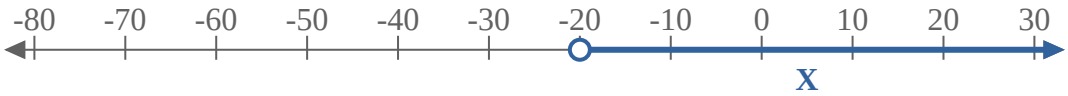

1)

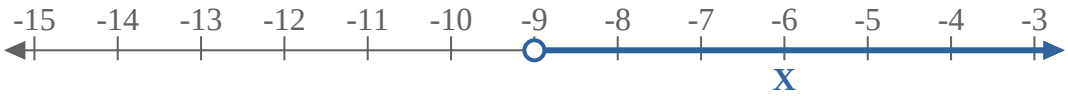

2)

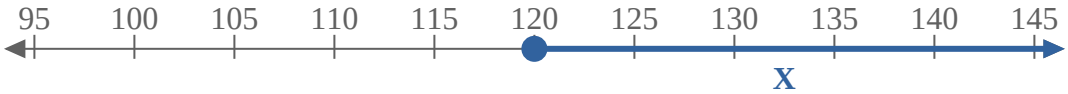

3)

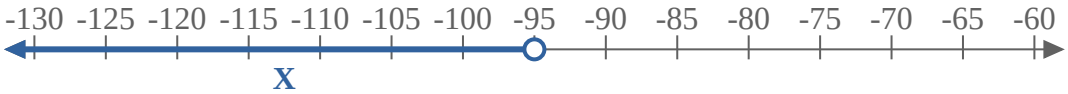

4)

5)

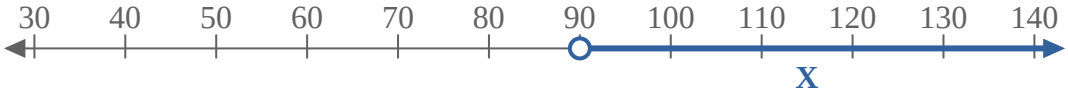

6)

7)

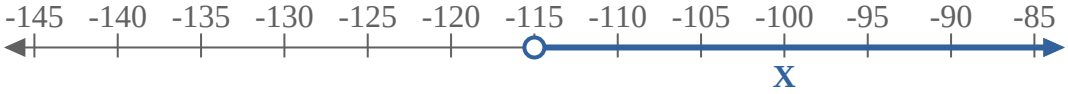

8)

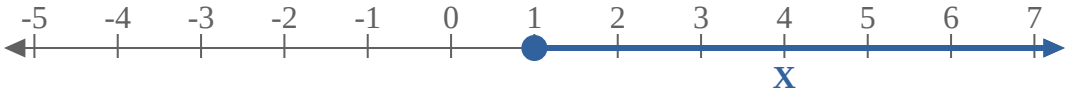

9)

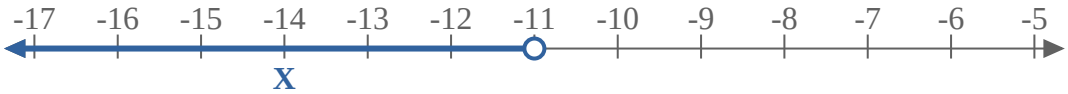

10)

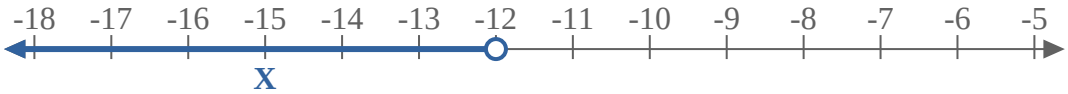

11)

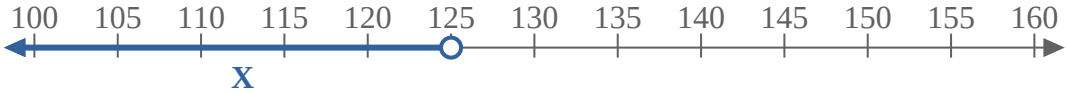

12)

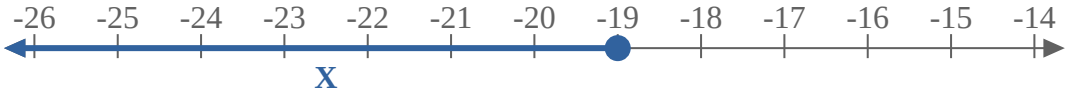

13)

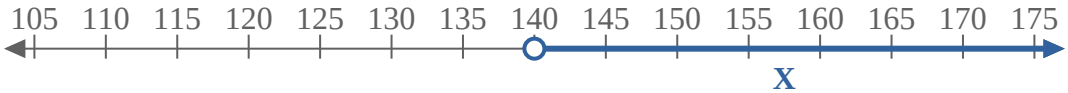

Réponses

Ex. X > -20

1. _____
2. _____
3. _____
4. _____
5. _____
6. _____
7. _____
8. _____
9. _____
10. _____
11. _____
12. _____
13. _____

1-10	92	85	77	69	62	54	46	38	31	23
11-13	15	8	0							

Ecrire des Inégalités à partir d'une Droite Numérique Nom: **Clé**

Ecrivez une inégalité à partir d'une droite numérique.

Ex)

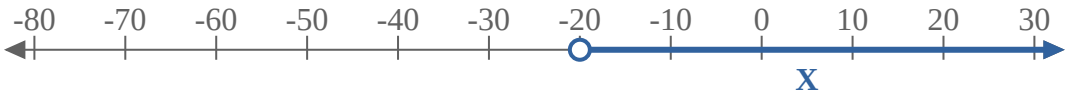

1)

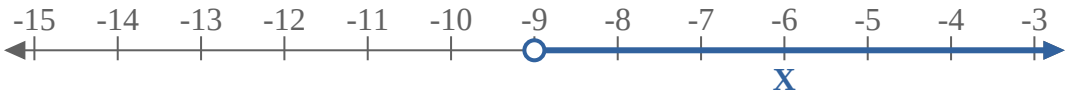

2)

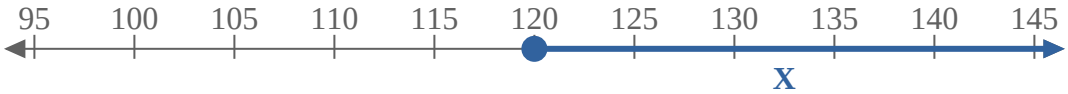

3)

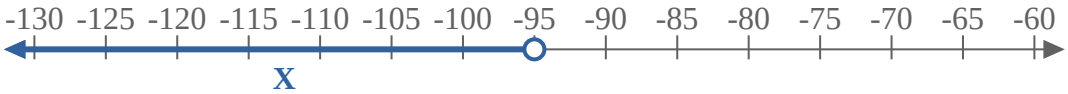

4)

5)

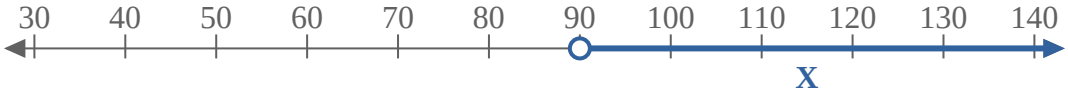

6)

7)

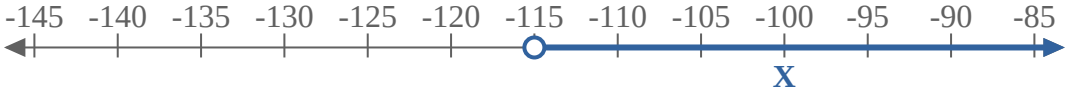

8)

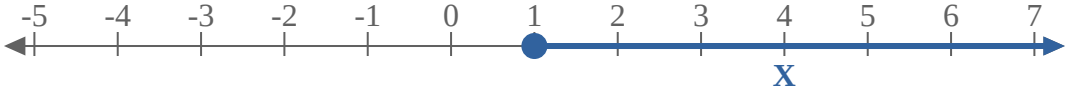

9)

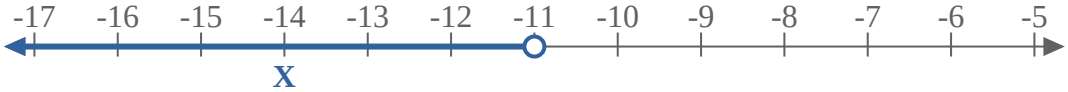

10)

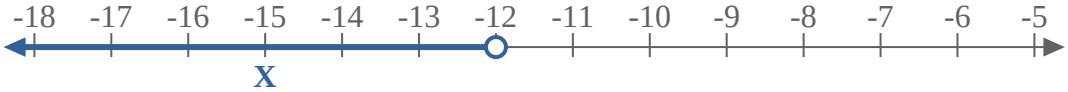

11)

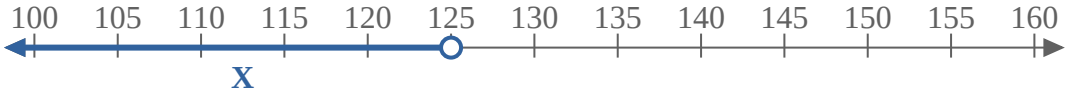

12)

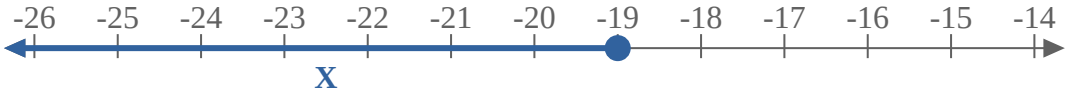

13)

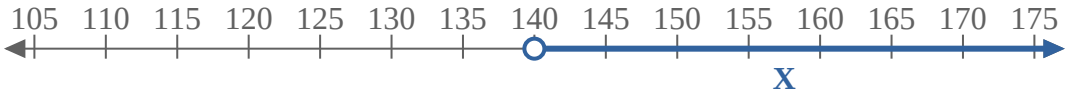

Réponses

Ex.	X > -20
1.	X > -9
2.	X ≥ 120
3.	X < -95
4.	X < -195
5.	X > 90
6.	X < 19
7.	X > -115
8.	X ≥ 1
9.	X < -11
10.	X < -12
11.	X < 125
12.	X ≤ -19
13.	X > 140

1-10	92	85	77	69	62	54	46	38	31	23
11-13	15	8	0							