Trouver la longueur de côté manquante du triangle rectangle (aire) Nom:

Trouvez la valeur de x.

1) Périmètre = 24 u

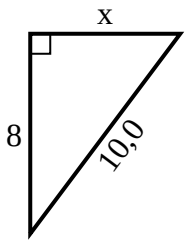

2) Périmètre = 13,8 u

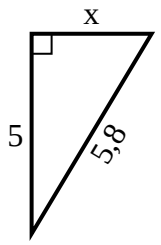

3) Périmètre = 15,7 u

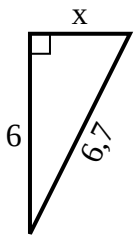

4) Périmètre = 12,4 u

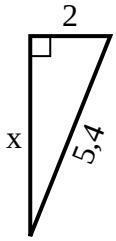

5) Périmètre = 25,8 u

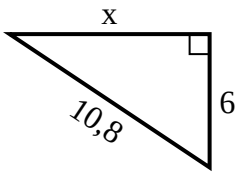

6) Périmètre = 25,6 u

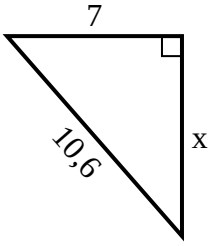

7) Périmètre = 13,8 u

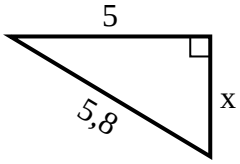

8) Périmètre = 22,4 u

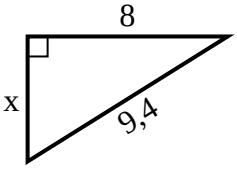

9) Périmètre = 12 u

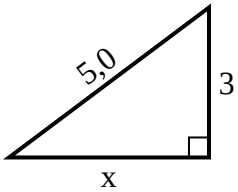

10) Périmètre = 18,2 u

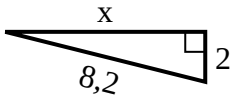

11) Périmètre = 19,1 u

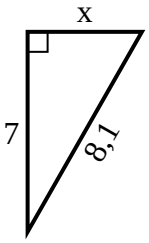

12) Périmètre = 27,4 u

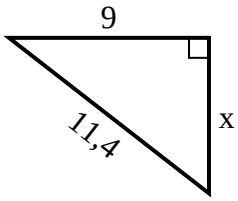

Réponses

1. _____
2. _____
3. _____
4. _____
5. _____
6. _____
7. _____
8. _____
9. _____
10. _____
11. _____
12. _____

1-10	92	83	75	67	58	50	42	33	25	17
11-12	8	0								

Trouver la longueur de côté manquante du triangle rectangle (aire) Nom: **Clé**

Trouvez la valeur de x.

1) Périmètre = 24 u

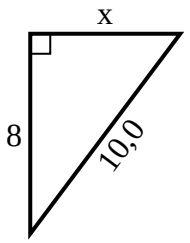

2) Périmètre = 13,8 u

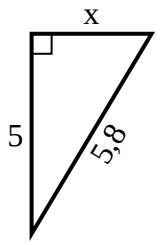

3) Périmètre = 15,7 u

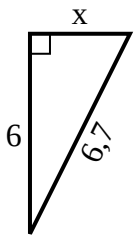

4) Périmètre = 12,4 u

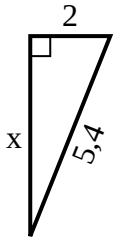

5) Périmètre = 25,8 u

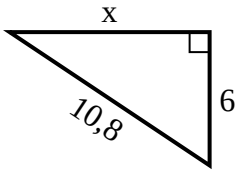

6) Périmètre = 25,6 u

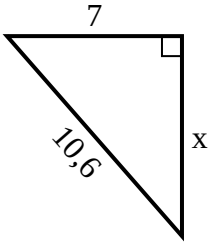

7) Périmètre = 13,8 u

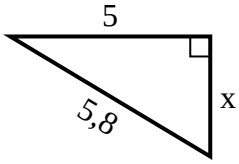

8) Périmètre = 22,4 u

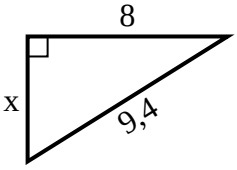

9) Périmètre = 12 u

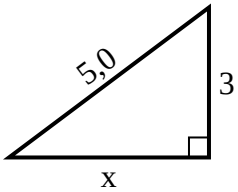

10) Périmètre = 18,2 u

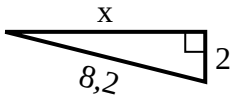

11) Périmètre = 19,1 u

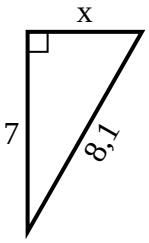

12) Périmètre = 27,4 u

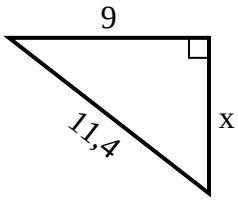

Réponses

1. 6
2. 3
3. 3
4. 5
5. 9
6. 8
7. 3
8. 5
9. 4
10. 8
11. 4
12. 7

1-10	92	83	75	67	58	50	42	33	25	17
11-12	8	0								