Trouvez la valeur de x.

1) Périmètre = 12 u

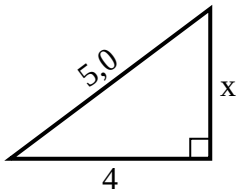

2) Périmètre = 10,5 u

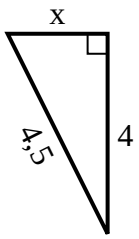

3) Périmètre = 24 u

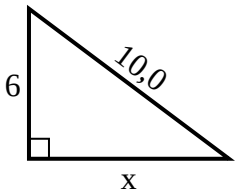

4) Périmètre = 13,7 u

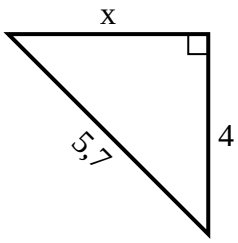

5) Périmètre = 17,2 u

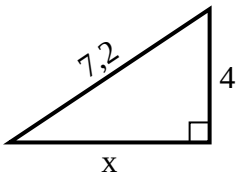

6) Périmètre = 14,3 u

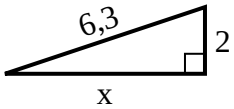

7) Périmètre = 17,2 u

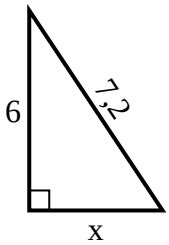

8) Périmètre = 21,5 u

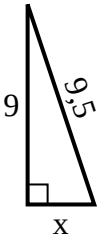

9) Périmètre = 20,9 u

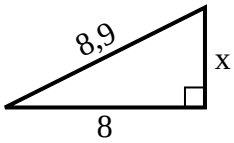

10) Périmètre = 17,6 u

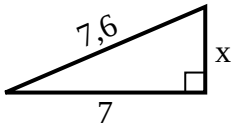

11) Périmètre = 22,4 u

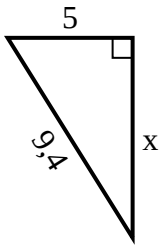

12) Périmètre = 22,2 u

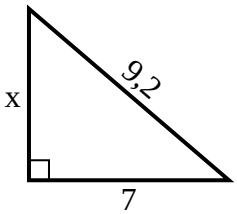

Réponses

1. _____
2. _____
3. _____
4. _____
5. _____
6. _____
7. _____
8. _____
9. _____
10. _____
11. _____
12. _____

1-10	92	83	75	67	58	50	42	33	25	17
11-12	8	0								

Trouver la longueur de côté manquante du triangle rectangle (aire) Nom: **Clé**

Trouvez la valeur de x.

1) Périmètre = 12 u

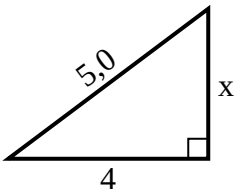

2) Périmètre = 10,5 u

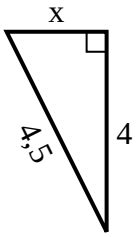

3) Périmètre = 24 u

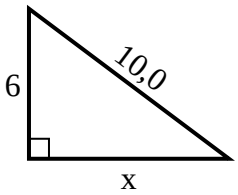

4) Périmètre = 13,7 u

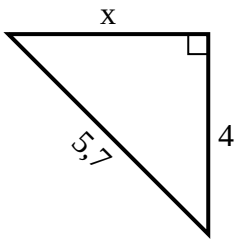

5) Périmètre = 17,2 u

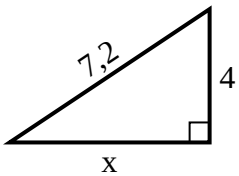

6) Périmètre = 14,3 u

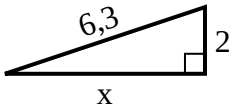

7) Périmètre = 17,2 u

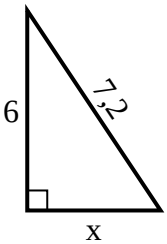

8) Périmètre = 21,5 u

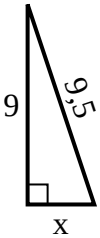

9) Périmètre = 20,9 u

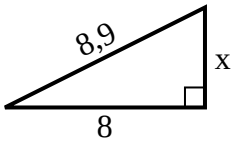

10) Périmètre = 17,6 u

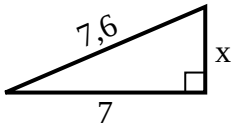

11) Périmètre = 22,4 u

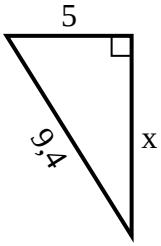

12) Périmètre = 22,2 u

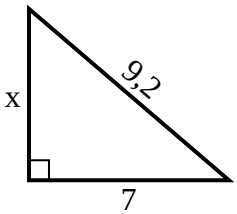

Réponses

1. **3**
2. **2**
3. **8**
4. **4**
5. **6**
6. **6**
7. **4**
8. **3**
9. **4**
10. **3**
11. **8**
12. **6**

1-10	92	83	75	67	58	50	42	33	25	17
11-12	8	0								