Trouver la longueur de côté manquante du triangle rectangle (aire) Nom:

Trouvez la valeur de x.

1) Périmètre = 24 u

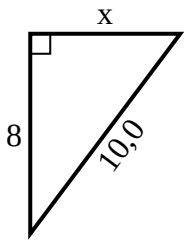

2) Périmètre = 13,8 u

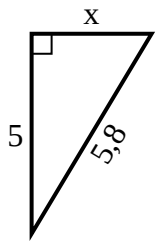

3) Périmètre = 15,7 u

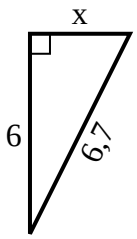

4) Périmètre = 12,4 u

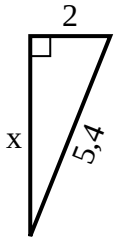

5) Périmètre = 25,8 u

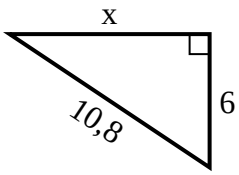

6) Périmètre = 25,6 u

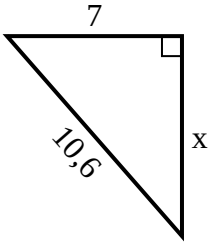

7) Périmètre = 13,8 u

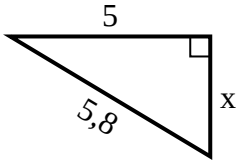

8) Périmètre = 22,4 u

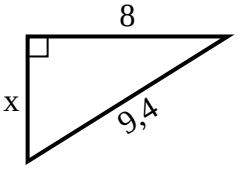

9) Périmètre = 12 u

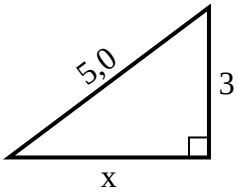

10) Périmètre = 18,2 u

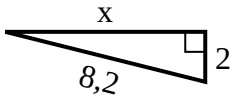

11) Périmètre = 19,1 u

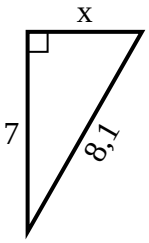

12) Périmètre = 27,4 u

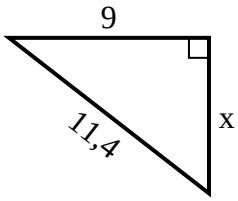

Réponses

1. _____
2. _____
3. _____
4. _____
5. _____
6. _____
7. _____
8. _____
9. _____
10. _____
11. _____
12. _____

1-10	92	83	75	67	58	50	42	33	25	17
11-12	8	0								

Trouver la longueur de côté manquante du triangle rectangle (aire) Nom: **Clé**

Trouvez la valeur de x.

1) Périmètre = 24 u

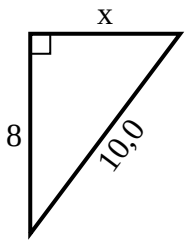

2) Périmètre = 13,8 u

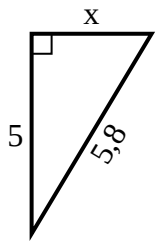

3) Périmètre = 15,7 u

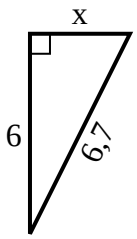

4) Périmètre = 12,4 u

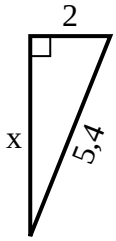

5) Périmètre = 25,8 u

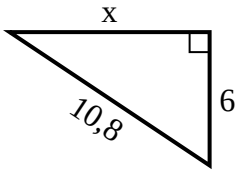

6) Périmètre = 25,6 u

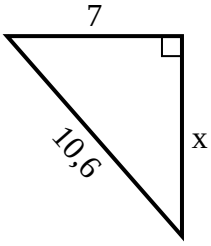

7) Périmètre = 13,8 u

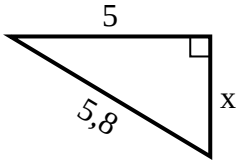

8) Périmètre = 22,4 u

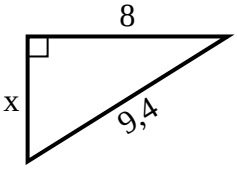

9) Périmètre = 12 u

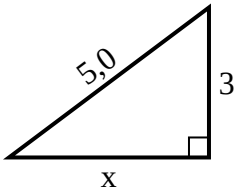

10) Périmètre = 18,2 u

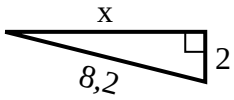

11) Périmètre = 19,1 u

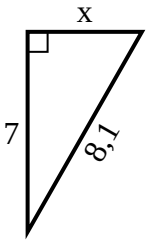

12) Périmètre = 27,4 u

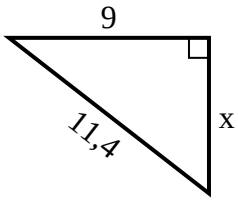

Réponses

1. 6
2. 3
3. 3
4. 5
5. 9
6. 8
7. 3
8. 5
9. 4
10. 8
11. 4
12. 7

1-10	92	83	75	67	58	50	42	33	25	17
11-12	8	0								

Trouvez la valeur de x.

1) Périmètre = 29 u

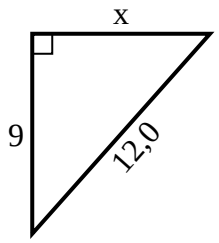

2) Périmètre = 10,2 u

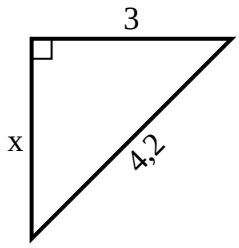

3) Périmètre = 8,6 u

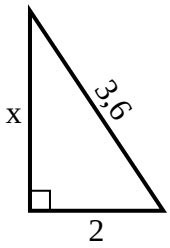

4) Périmètre = 18,2 u

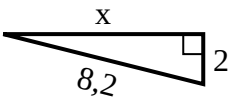

5) Périmètre = 20,6 u

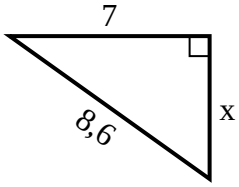

6) Périmètre = 19,5 u

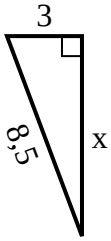

7) Périmètre = 27,3 u

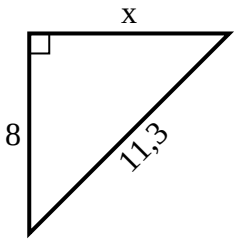

8) Périmètre = 10,5 u

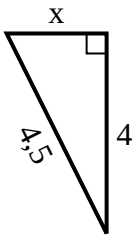

9) Périmètre = 15,4 u

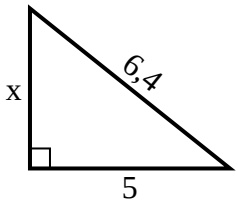

10) Périmètre = 24,3 u

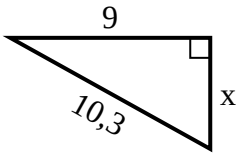

11) Périmètre = 25,8 u

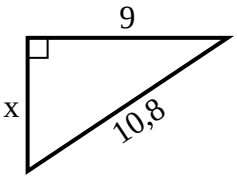

12) Périmètre = 13,8 u

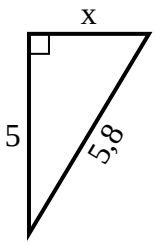

Réponses

1. _____
2. _____
3. _____
4. _____
5. _____
6. _____
7. _____
8. _____
9. _____
10. _____
11. _____
12. _____

1-10	92	83	75	67	58	50	42	33	25	17
11-12	8	0								

Trouver la longueur de côté manquante du triangle rectangle (aire) Nom: **Clé**

Trouvez la valeur de x.

1) Périmètre = 29 u

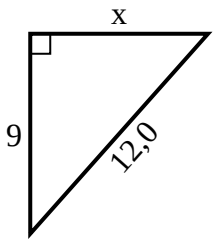

2) Périmètre = 10,2 u

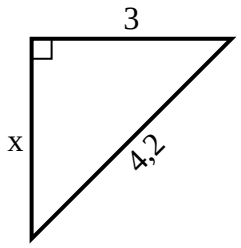

3) Périmètre = 8,6 u

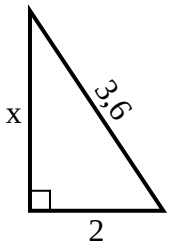

4) Périmètre = 18,2 u

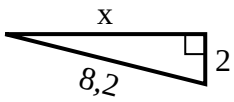

5) Périmètre = 20,6 u

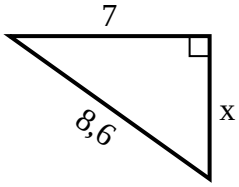

6) Périmètre = 19,5 u

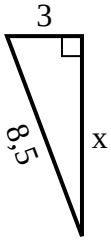

7) Périmètre = 27,3 u

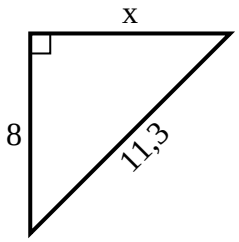

8) Périmètre = 10,5 u

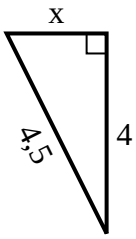

9) Périmètre = 15,4 u

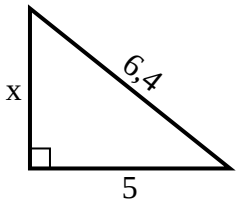

10) Périmètre = 24,3 u

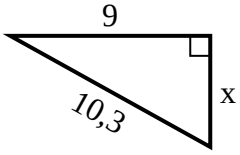

11) Périmètre = 25,8 u

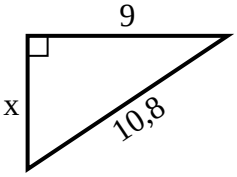

12) Périmètre = 13,8 u

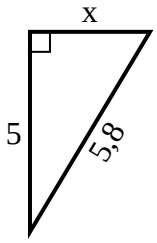

Réponses

1. 8
2. 3
3. 3
4. 8
5. 5
6. 8
7. 8
8. 2
9. 4
10. 5
11. 6
12. 3

1-10	92	83	75	67	58	50	42	33	25	17
11-12	8	0								

Trouvez la valeur de x.

1) Périmètre = 20,9 u

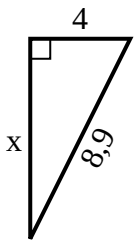

2) Périmètre = 21,5 u

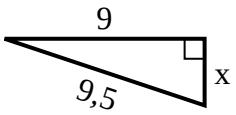

3) Périmètre = 14,3 u

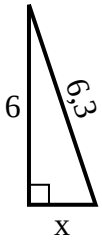

4) Périmètre = 18,2 u

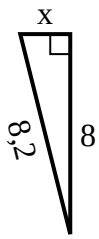

5) Périmètre = 19,1 u

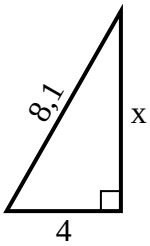

6) Périmètre = 22,2 u

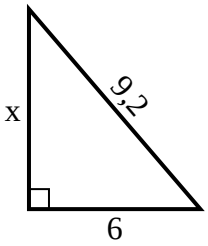

7) Périmètre = 22,8 u

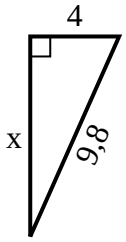

8) Périmètre = 29 u

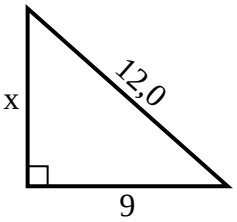

9) Périmètre = 25,8 u

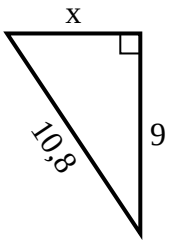

10) Périmètre = 20,6 u

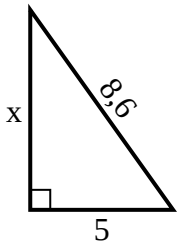

11) Périmètre = 6,8 u

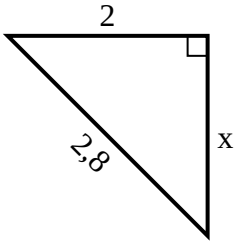

12) Périmètre = 21,5 u

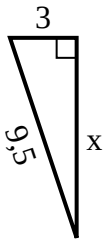

Réponses

1. _____
2. _____
3. _____
4. _____
5. _____
6. _____
7. _____
8. _____
9. _____
10. _____
11. _____
12. _____

1-10	92	83	75	67	58	50	42	33	25	17
11-12	8	0								

Trouver la longueur de côté manquante du triangle rectangle (aire) Nom: **Clé**

Trouvez la valeur de x.

1) Périmètre = 20,9 u

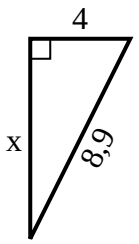

2) Périmètre = 21,5 u

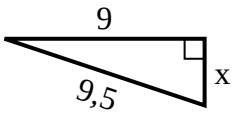

3) Périmètre = 14,3 u

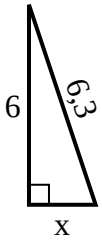

4) Périmètre = 18,2 u

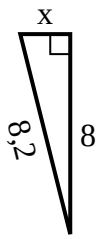

5) Périmètre = 19,1 u

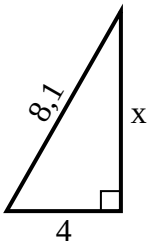

6) Périmètre = 22,2 u

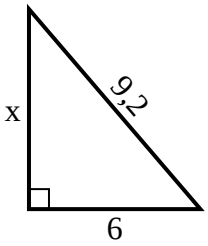

7) Périmètre = 22,8 u

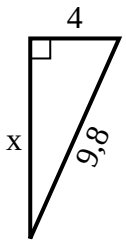

8) Périmètre = 29 u

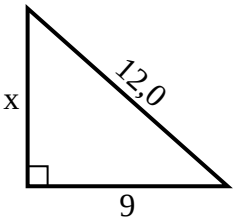

9) Périmètre = 25,8 u

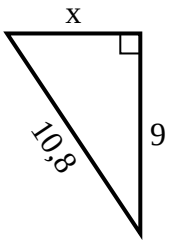

10) Périmètre = 20,6 u

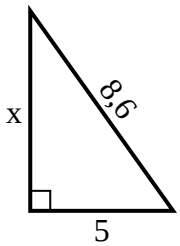

11) Périmètre = 6,8 u

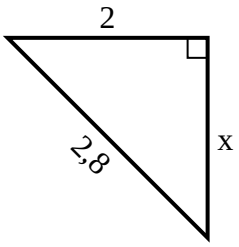

12) Périmètre = 21,5 u

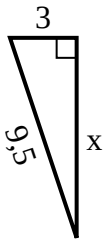

Réponses

1. 8
2. 3
3. 2
4. 2
5. 7
6. 7
7. 9
8. 8
9. 6
10. 7
11. 2
12. 9

1-10	92	83	75	67	58	50	42	33	25	17
11-12	8	0								

Trouvez la valeur de x.

1) Périmètre = 22,4 u

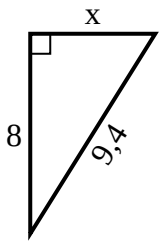

2) Périmètre = 27,3 u

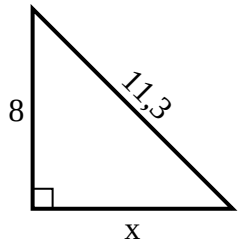

3) Périmètre = 17,2 u

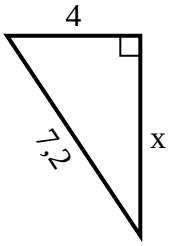

4) Périmètre = 29 u

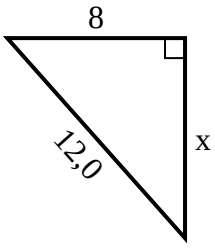

5) Périmètre = 20,9 u

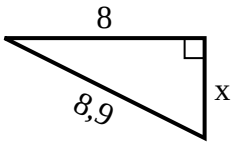

6) Périmètre = 8,6 u

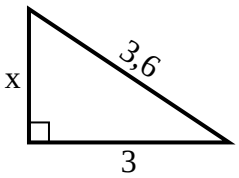

7) Périmètre = 17,6 u

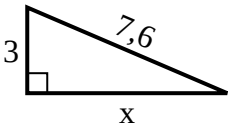

8) Périmètre = 22,8 u

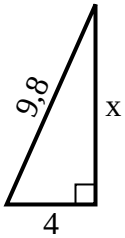

9) Périmètre = 10,5 u

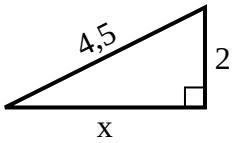

10) Périmètre = 22,2 u

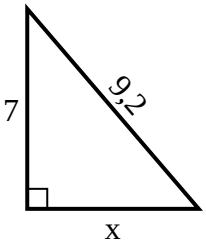

11) Périmètre = 22,4 u

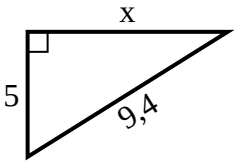

12) Périmètre = 17,2 u

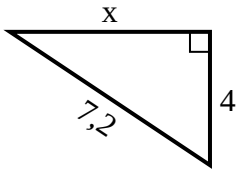

Réponses

1. _____
2. _____
3. _____
4. _____
5. _____
6. _____
7. _____
8. _____
9. _____
10. _____
11. _____
12. _____

1-10	92	83	75	67	58	50	42	33	25	17
11-12	8	0								

Trouver la longueur de côté manquante du triangle rectangle (aire) Nom: **Clé**

Trouvez la valeur de x.

1) Périmètre = 22,4 u

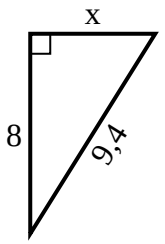

2) Périmètre = 27,3 u

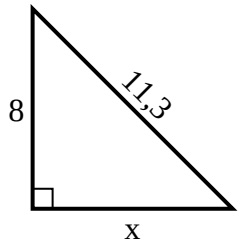

3) Périmètre = 17,2 u

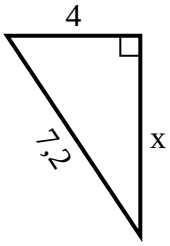

4) Périmètre = 29 u

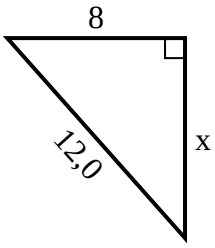

5) Périmètre = 20,9 u

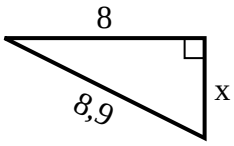

6) Périmètre = 8,6 u

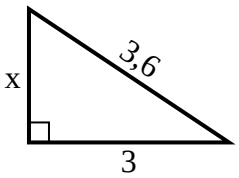

7) Périmètre = 17,6 u

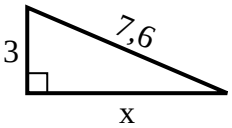

8) Périmètre = 22,8 u

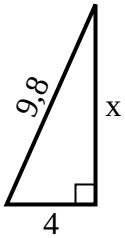

9) Périmètre = 10,5 u

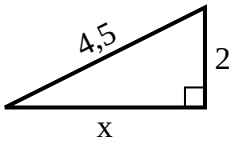

10) Périmètre = 22,2 u

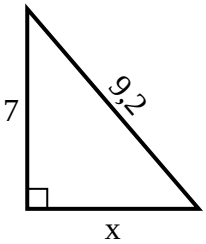

11) Périmètre = 22,4 u

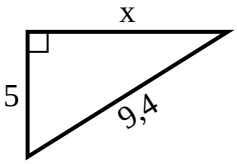

12) Périmètre = 17,2 u

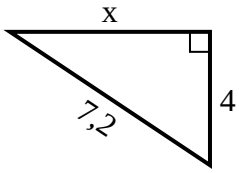

Réponses

1. 5
2. 8
3. 6
4. 9
5. 4
6. 2
7. 7
8. 9
9. 4
10. 6
11. 8
12. 6

1-10	92	83	75	67	58	50	42	33	25	17
11-12	8	0								

Trouvez la valeur de x.

1) Périmètre = 20,2 u

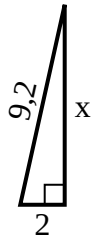

2) Périmètre = 27,4 u

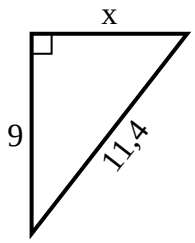

3) Périmètre = 18,8 u

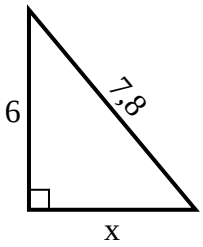

4) Périmètre = 20,6 u

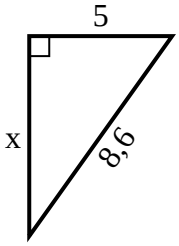

5) Périmètre = 6,8 u

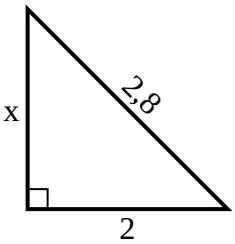

6) Périmètre = 17,6 u

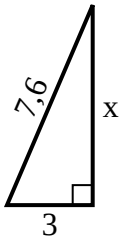

7) Périmètre = 20,6 u

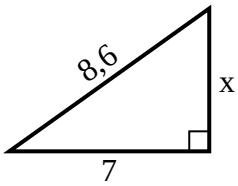

8) Périmètre = 24,3 u

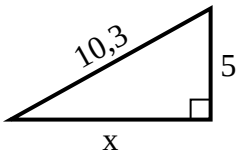

9) Périmètre = 15,4 u

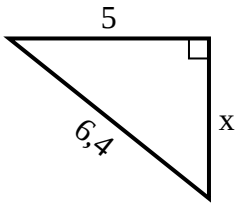

10) Périmètre = 19,5 u

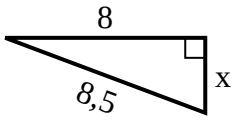

11) Périmètre = 16,3 u

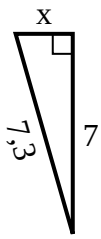

12) Périmètre = 17,6 u

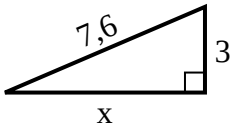

Réponses

1. _____
2. _____
3. _____
4. _____
5. _____
6. _____
7. _____
8. _____
9. _____
10. _____
11. _____
12. _____

1-10	92	83	75	67	58	50	42	33	25	17
11-12	8	0								

Trouver la longueur de côté manquante du triangle rectangle (aire) Nom: **Clé**

Trouvez la valeur de x.

1) Périmètre = 20,2 u

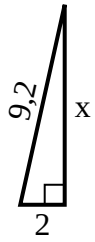

2) Périmètre = 27,4 u

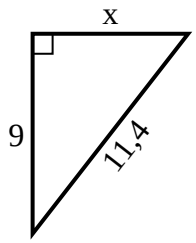

3) Périmètre = 18,8 u

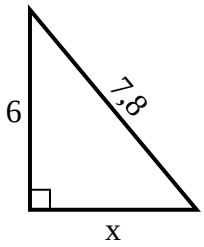

4) Périmètre = 20,6 u

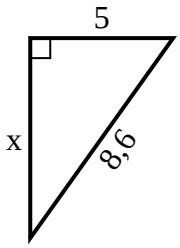

5) Périmètre = 6,8 u

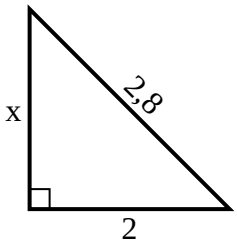

6) Périmètre = 17,6 u

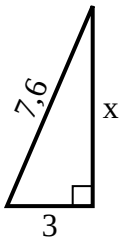

7) Périmètre = 20,6 u

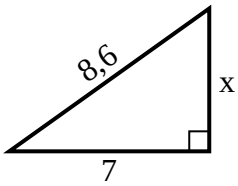

8) Périmètre = 24,3 u

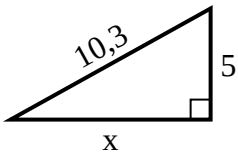

9) Périmètre = 15,4 u

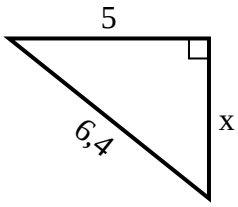

10) Périmètre = 19,5 u

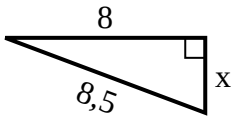

11) Périmètre = 16,3 u

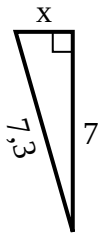

12) Périmètre = 17,6 u

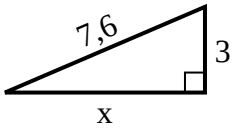

Réponses

1. 9
2. 7
3. 5
4. 7
5. 2
6. 7
7. 5
8. 9
9. 4
10. 3
11. 2
12. 7

1-10	92	83	75	67	58	50	42	33	25	17
11-12	8	0								

Trouvez la valeur de x.

1) Périmètre = 16,3 u

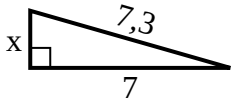

2) Périmètre = 17,2 u

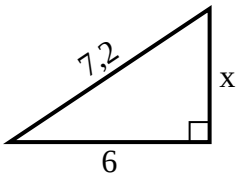

3) Périmètre = 15,4 u

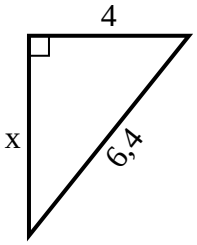

4) Périmètre = 20,9 u

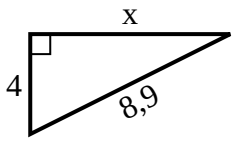

5) Périmètre = 22,8 u

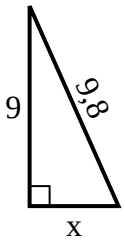

6) Périmètre = 17,6 u

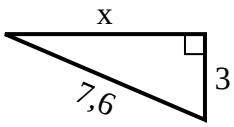

7) Périmètre = 24,3 u

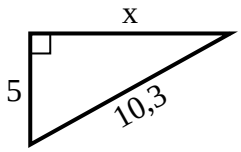

8) Périmètre = 22,4 u

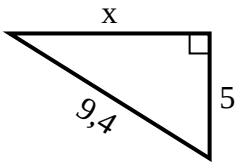

9) Périmètre = 12,4 u

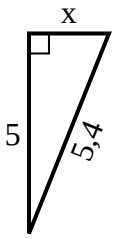

10) Périmètre = 20,6 u

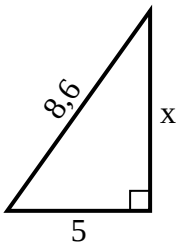

11) Périmètre = 13,8 u

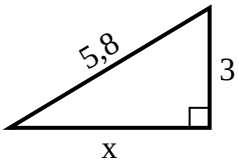

12) Périmètre = 19,5 u

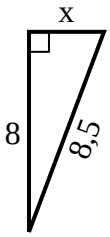

Réponses

1. _____
2. _____
3. _____
4. _____
5. _____
6. _____
7. _____
8. _____
9. _____
10. _____
11. _____
12. _____

1-10	92	83	75	67	58	50	42	33	25	17
11-12	8	0								

Trouver la longueur de côté manquante du triangle rectangle (aire) Nom: **Clé**

Trouvez la valeur de x.

1) Périmètre = 16,3 u

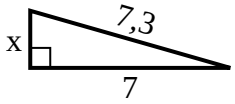

2) Périmètre = 17,2 u

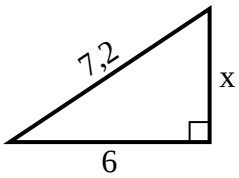

3) Périmètre = 15,4 u

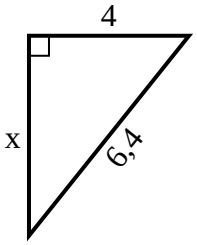

4) Périmètre = 20,9 u

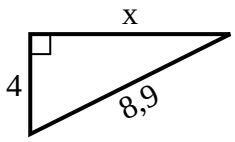

5) Périmètre = 22,8 u

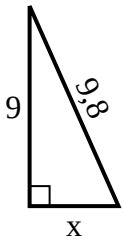

6) Périmètre = 17,6 u

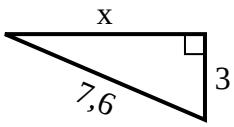

7) Périmètre = 24,3 u

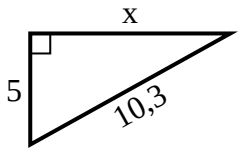

8) Périmètre = 22,4 u

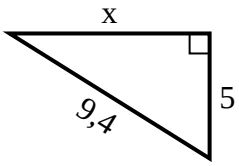

9) Périmètre = 12,4 u

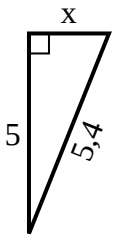

10) Périmètre = 20,6 u

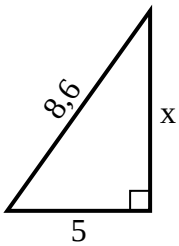

11) Périmètre = 13,8 u

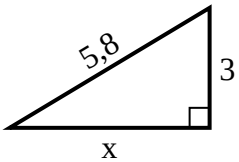

12) Périmètre = 19,5 u

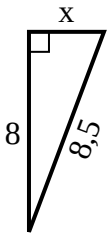

Réponses

1. 2
2. 4
3. 5
4. 8
5. 4
6. 7
7. 9
8. 8
9. 2
10. 7
11. 5
12. 3

1-10	92	83	75	67	58	50	42	33	25	17
11-12	8	0								

Trouvez la valeur de x.

1) Périmètre = 13,8 u

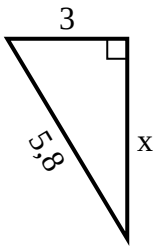

2) Périmètre = 15,7 u

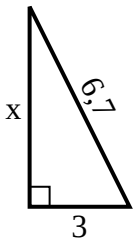

3) Périmètre = 27,3 u

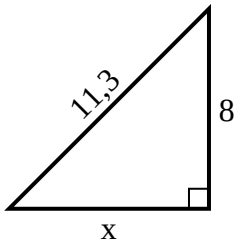

4) Périmètre = 30,7 u

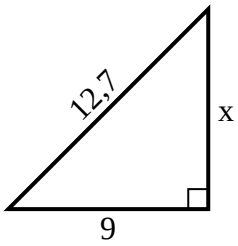

5) Périmètre = 20,2 u

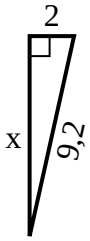

6) Périmètre = 23,9 u

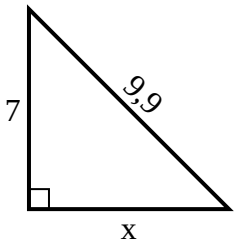

7) Périmètre = 14,3 u

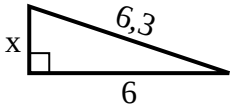

8) Périmètre = 22,2 u

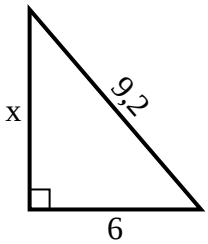

9) Périmètre = 20,5 u

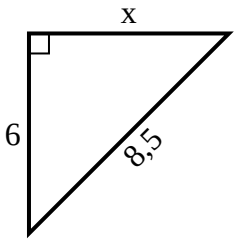

10) Périmètre = 20,9 u

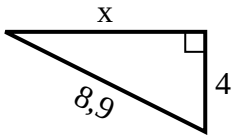

11) Périmètre = 12 u

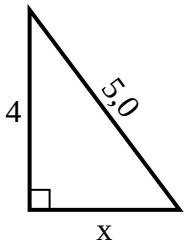

12) Périmètre = 24,3 u

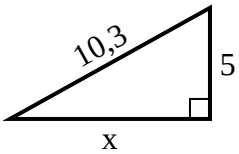

Réponses

1. _____
2. _____
3. _____
4. _____
5. _____
6. _____
7. _____
8. _____
9. _____
10. _____
11. _____
12. _____

1-10	92	83	75	67	58	50	42	33	25	17
11-12	8	0								

Trouver la longueur de côté manquante du triangle rectangle (aire) Nom: **Clé**

Trouvez la valeur de x.

1) Périmètre = 13,8 u

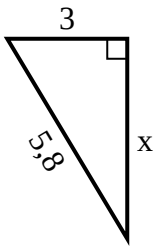

2) Périmètre = 15,7 u

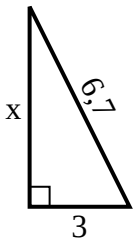

3) Périmètre = 27,3 u

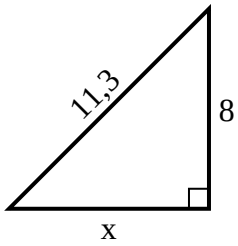

4) Périmètre = 30,7 u

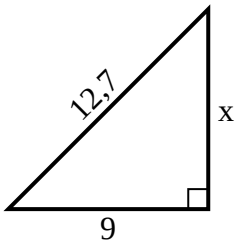

5) Périmètre = 20,2 u

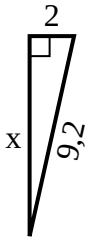

6) Périmètre = 23,9 u

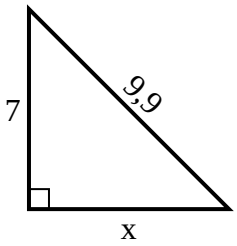

7) Périmètre = 14,3 u

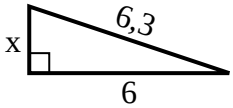

8) Périmètre = 22,2 u

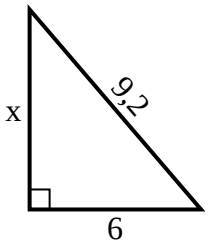

9) Périmètre = 20,5 u

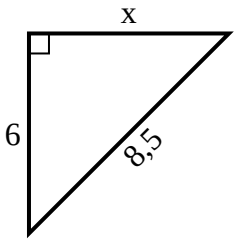

10) Périmètre = 20,9 u

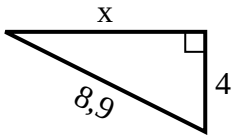

11) Périmètre = 12 u

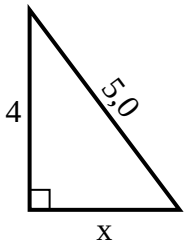

12) Périmètre = 24,3 u

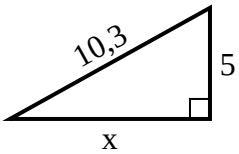

Réponses

1. 5
2. 6
3. 8
4. 9
5. 9
6. 7
7. 2
8. 7
9. 6
10. 8
11. 3
12. 9

1-10	92	83	75	67	58	50	42	33	25	17
11-12	8	0								

Trouvez la valeur de x.

1) Périmètre = 12 u

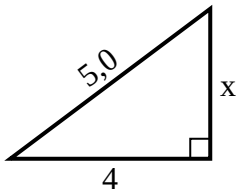

2) Périmètre = 10,5 u

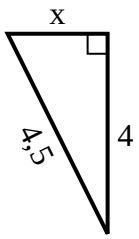

3) Périmètre = 24 u

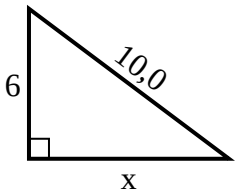

4) Périmètre = 13,7 u

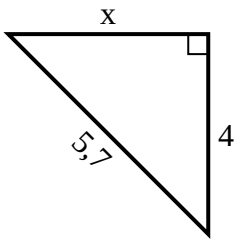

5) Périmètre = 17,2 u

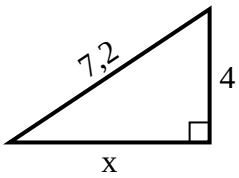

6) Périmètre = 14,3 u

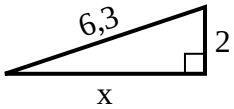

7) Périmètre = 17,2 u

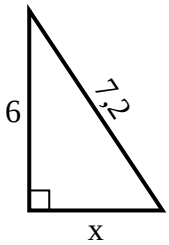

8) Périmètre = 21,5 u

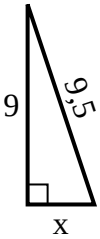

9) Périmètre = 20,9 u

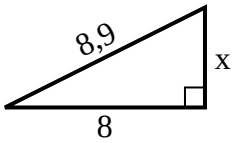

10) Périmètre = 17,6 u

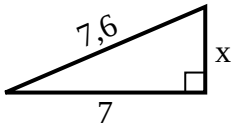

11) Périmètre = 22,4 u

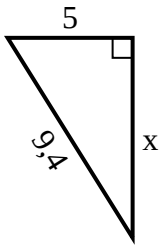

12) Périmètre = 22,2 u

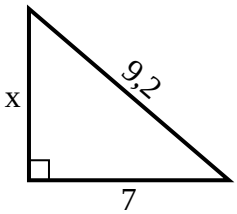

Réponses

1. _____
2. _____
3. _____
4. _____
5. _____
6. _____
7. _____
8. _____
9. _____
10. _____
11. _____
12. _____

1-10	92	83	75	67	58	50	42	33	25	17
11-12	8	0								

Trouver la longueur de côté manquante du triangle rectangle (aire) Nom: **Clé**

Trouvez la valeur de x.

1) Périmètre = 12 u

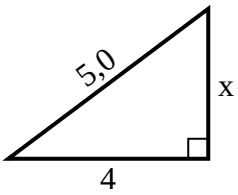

2) Périmètre = 10,5 u

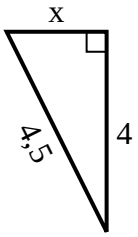

3) Périmètre = 24 u

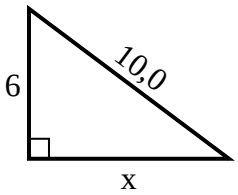

4) Périmètre = 13,7 u

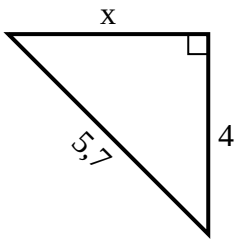

5) Périmètre = 17,2 u

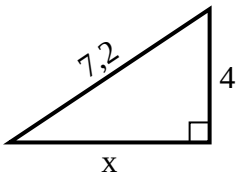

6) Périmètre = 14,3 u

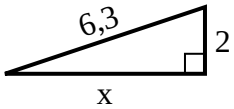

7) Périmètre = 17,2 u

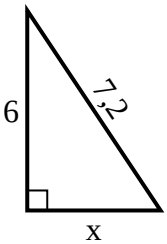

8) Périmètre = 21,5 u

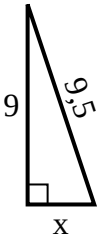

9) Périmètre = 20,9 u

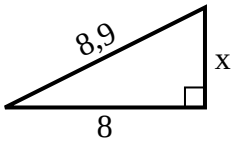

10) Périmètre = 17,6 u

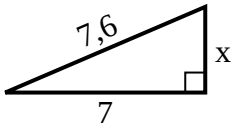

11) Périmètre = 22,4 u

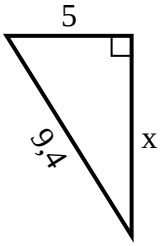

12) Périmètre = 22,2 u

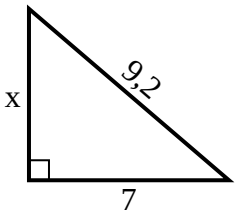

Réponses

1. **3**
2. **2**
3. **8**
4. **4**
5. **6**
6. **6**
7. **4**
8. **3**
9. **4**
10. **3**
11. **8**
12. **6**

1-10	92	83	75	67	58	50	42	33	25	17
11-12	8	0								

Trouvez la valeur de x.

1) Périmètre = 18,8 u

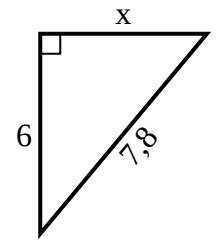

2) Périmètre = 8,6 u

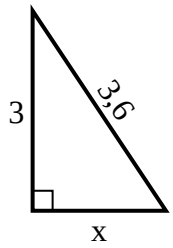

3) Périmètre = 14,3 u

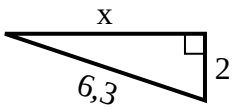

4) Périmètre = 17,1 u

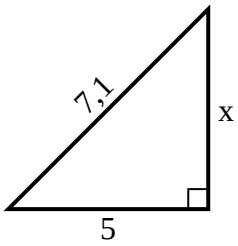

5) Périmètre = 22,2 u

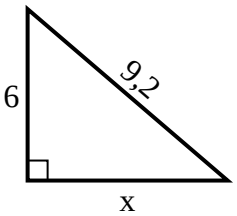

6) Périmètre = 13,8 u

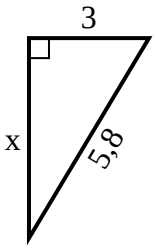

7) Périmètre = 25,8 u

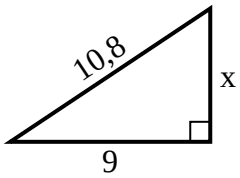

8) Périmètre = 20,9 u

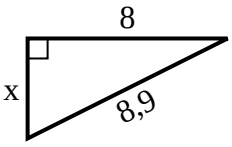

9) Périmètre = 25,6 u

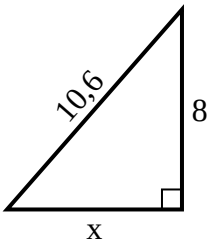

10) Périmètre = 29 u

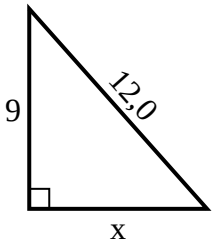

11) Périmètre = 15,4 u

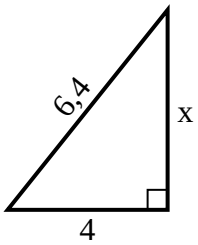

12) Périmètre = 10,5 u

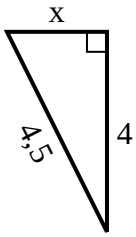

Réponses

1. _____
2. _____
3. _____
4. _____
5. _____
6. _____
7. _____
8. _____
9. _____
10. _____
11. _____
12. _____

1-10	92	83	75	67	58	50	42	33	25	17
11-12	8	0								

Trouver la longueur de côté manquante du triangle rectangle (aire) Nom: **Clé**

Trouvez la valeur de x.

1) Périmètre = 18,8 u

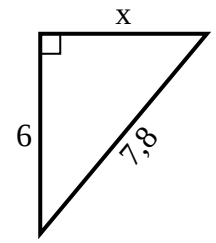

2) Périmètre = 8,6 u

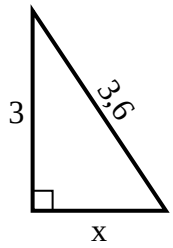

3) Périmètre = 14,3 u

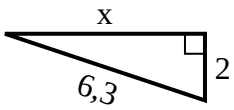

4) Périmètre = 17,1 u

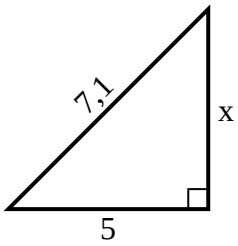

5) Périmètre = 22,2 u

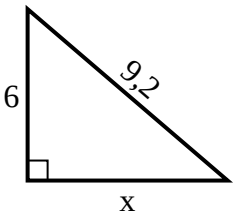

6) Périmètre = 13,8 u

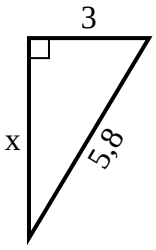

7) Périmètre = 25,8 u

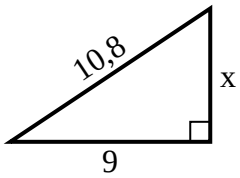

8) Périmètre = 20,9 u

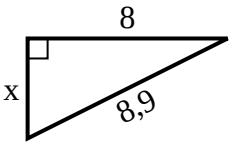

9) Périmètre = 25,6 u

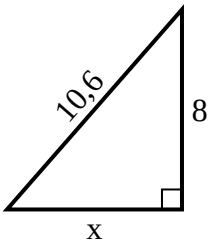

10) Périmètre = 29 u

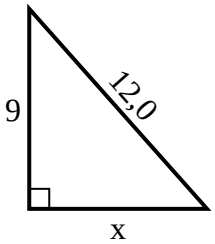

11) Périmètre = 15,4 u

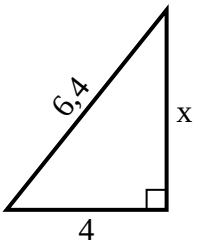

12) Périmètre = 10,5 u

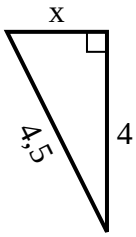

Réponses

1. 5
2. 2
3. 6
4. 5
5. 7
6. 5
7. 6
8. 4
9. 7
10. 8
11. 5
12. 2

1-10	92	83	75	67	58	50	42	33	25	17
11-12	8	0								

Trouvez la valeur de x.

1) Périmètre = 25,8 u

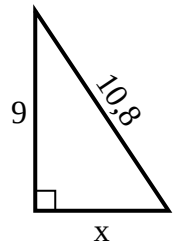

2) Périmètre = 24,3 u

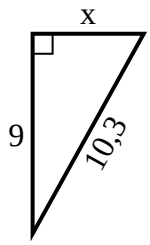

3) Périmètre = 15,7 u

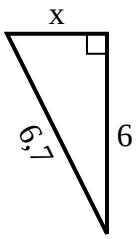

4) Périmètre = 19,5 u

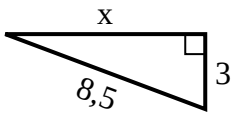

5) Périmètre = 29 u

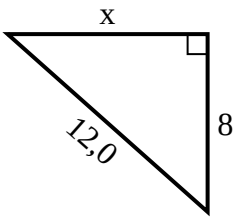

6) Périmètre = 10,5 u

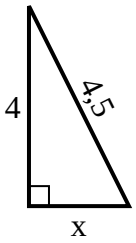

7) Périmètre = 25,6 u

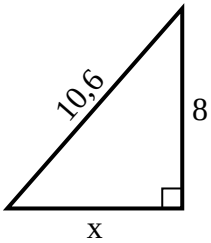

8) Périmètre = 14,3 u

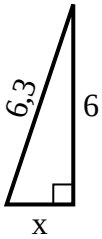

9) Périmètre = 22,4 u

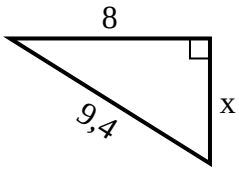

10) Périmètre = 27,4 u

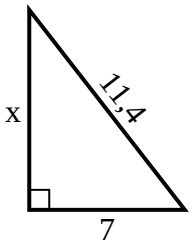

11) Périmètre = 6,8 u

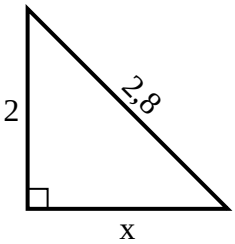

12) Périmètre = 27,3 u

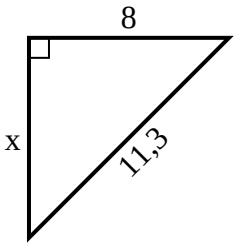

Réponses

1. _____
2. _____
3. _____
4. _____
5. _____
6. _____
7. _____
8. _____
9. _____
10. _____
11. _____
12. _____

1-10	92	83	75	67	58	50	42	33	25	17
11-12	8	0								

Trouver la longueur de côté manquante du triangle rectangle (aire) Nom: **Clé**

Trouvez la valeur de x.

1) Périmètre = 25,8 u

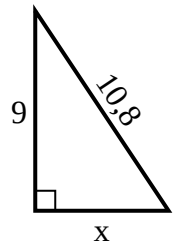

2) Périmètre = 24,3 u

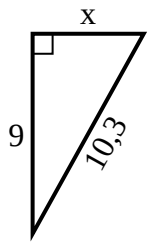

3) Périmètre = 15,7 u

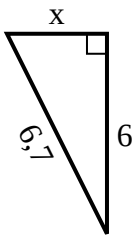

4) Périmètre = 19,5 u

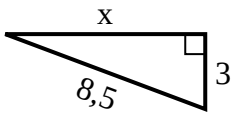

5) Périmètre = 29 u

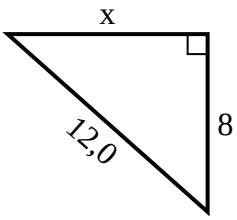

6) Périmètre = 10,5 u

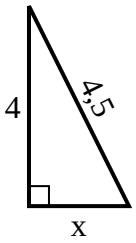

7) Périmètre = 25,6 u

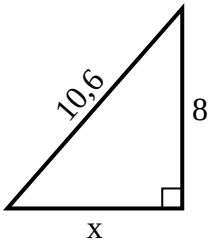

8) Périmètre = 14,3 u

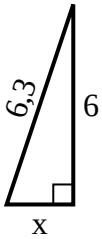

9) Périmètre = 22,4 u

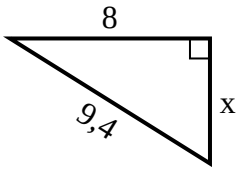

10) Périmètre = 27,4 u

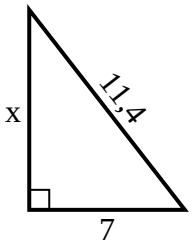

11) Périmètre = 6,8 u

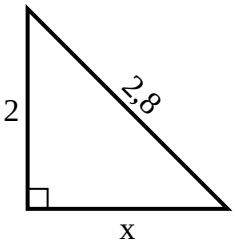

12) Périmètre = 27,3 u

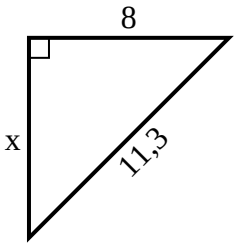

Réponses

1. 6
2. 5
3. 3
4. 8
5. 9
6. 2
7. 7
8. 2
9. 5
10. 9
11. 2
12. 8

1-10	92	83	75	67	58	50	42	33	25	17
11-12	8	0								