Indiquer l'angle de chaque figure

Nom:

Dénombrez le nombre angles Aigus, Obtus, Droits, Rentrants de chaque figure.

Ex)

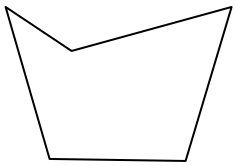

1)



2)

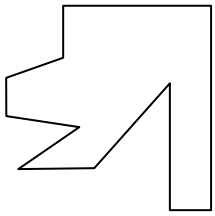

3)

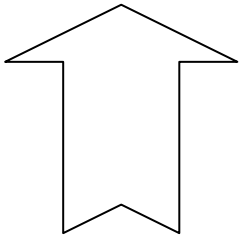

4)

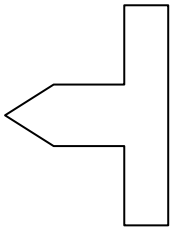

5)

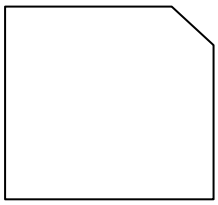

6)

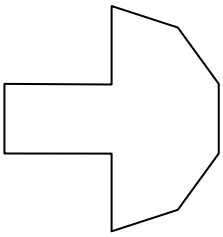

7)

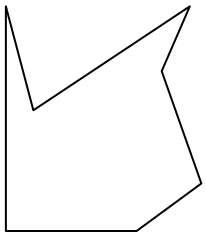

8)

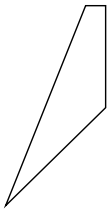

9)



10)



11)

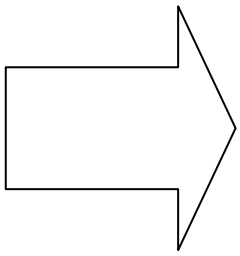

Réponses

Ex.	2	2	0	1
1.				
2.				
3.				
4.				
5.				
6.				
7.				
8.				
9.				
10.				
11.				

1-10	91	82	73	64	55	45	36	27	18	9
11	0									

Indiquer l'angle de chaque figure

Nom: **Clé**

Dénombrez le nombre angles Aigus, Obtus, Droits, Rentrants de chaque figure.

Ex)

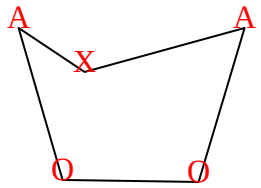

1)

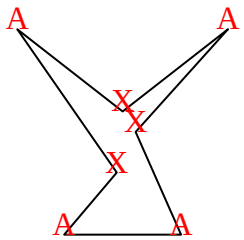

2)

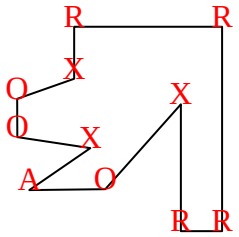

3)

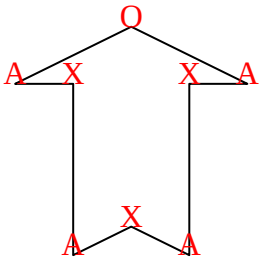

4)

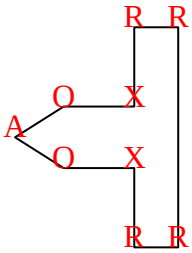

5)

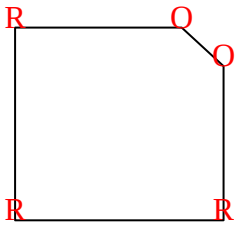

6)

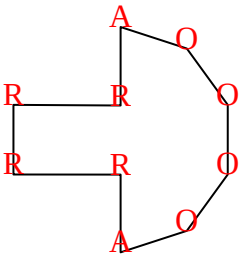

7)

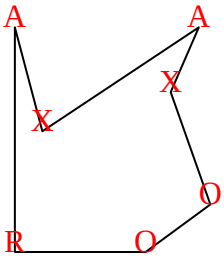

8)

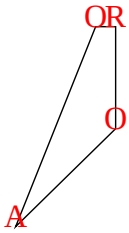

9)

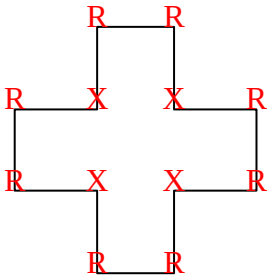

10)

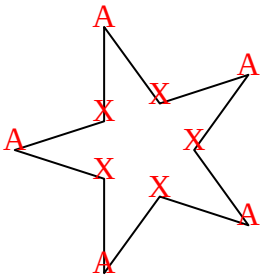

11)

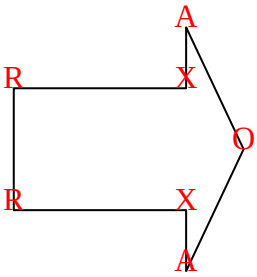

Réponses

Ex.	2	2	0	1
1.	4	0	0	3
2.	1	3	4	3
3.	4	1	0	3
4.	1	2	4	2
5.	0	2	3	0
6.	2	4	4	0
7.	2	2	1	2
8.	1	2	1	0
9.	0	0	8	4
10.	5	0	0	5
11.	2	1	2	2

1-10	91	82	73	64	55	45	36	27	18	9
11	0									