Décomposer en Petites Unités de Mesure

Nom:

Déterminez la plus petite fraction qui peut être faite à partir d'une plus grosse pièce.

Ex) $8\frac{4}{5}$

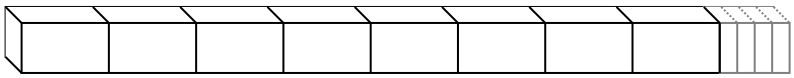

1) $5\frac{3}{5}$

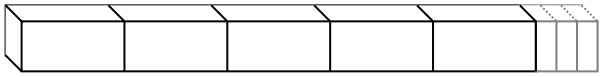

2) $5\frac{3}{5}$

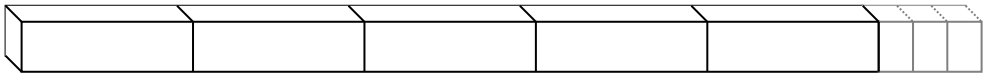

3) $2\frac{2}{3}$



4) $5\frac{1}{4}$



5) $2\frac{1}{4}$



6) $9\frac{3}{4}$

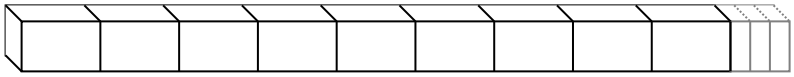

7) $5\frac{4}{5}$

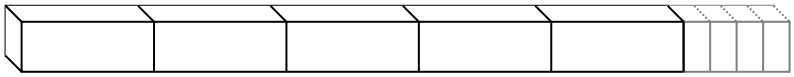

8) $7\frac{2}{4}$

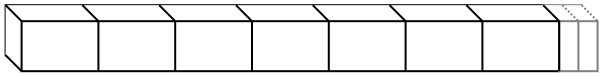

9) $4\frac{2}{3}$



10) $7\frac{3}{4}$

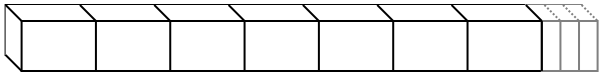

Réponses

Ex. 44

1. _____
2. _____
3. _____
4. _____
5. _____
6. _____
7. _____
8. _____
9. _____
10. _____

1-10	90	80	70	60	50	40	30	20	10	0

Décomposer en Petites Unités de Mesure Nom: **Clé**

Déterminez la plus petite fraction qui peut être faite à partir d'une plus grosse pièce.

Ex) $8\frac{4}{5}$

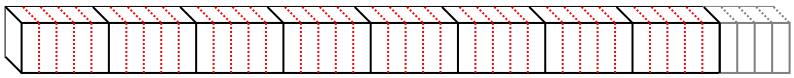

1) $5\frac{3}{5}$

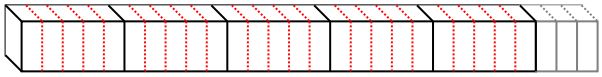

2) $5\frac{3}{5}$

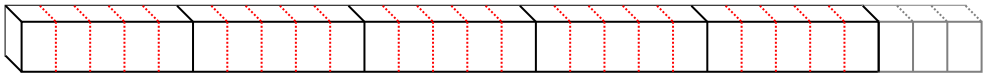

3) $2\frac{2}{3}$

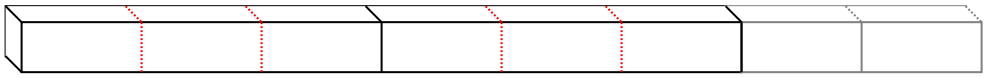

4) $5\frac{1}{4}$

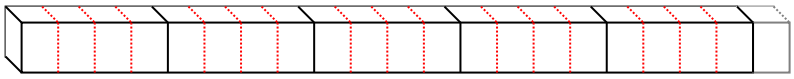

5) $2\frac{1}{4}$



6) $9\frac{3}{4}$

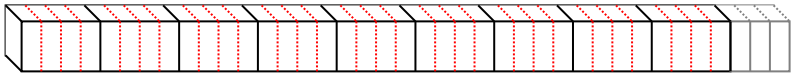

7) $5\frac{4}{5}$

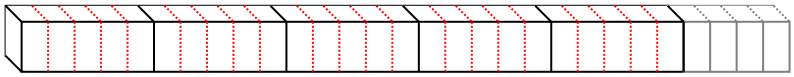

8) $7\frac{2}{4}$

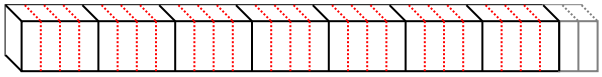

9) $4\frac{2}{3}$

10) $7\frac{3}{4}$

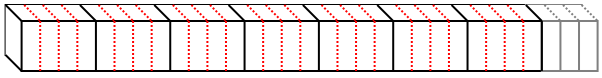

Réponses

Ex.	44
1.	28
2.	28
3.	8
4.	21
5.	9
6.	39
7.	29
8.	30
9.	14
10.	31