Recherche de volume avec des cubes unitaires Nom:

**Trouvez la longueur, la largeur et la hauteur du prisme rectangulaire. Trouvez ensuite le volume.**

**Ex)**

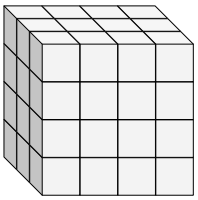

**1)**

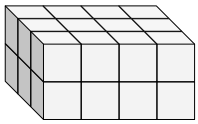

**2)**

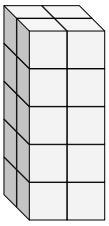

**3)**

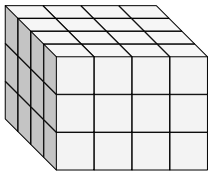

**4)**

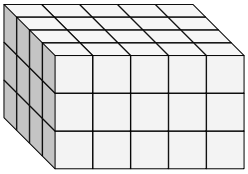

**5)**

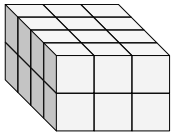

**6)**

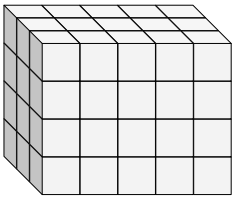

**7)**

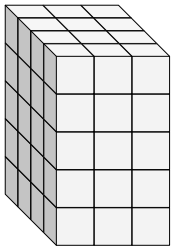

**8)**

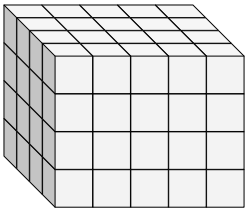

**9)**

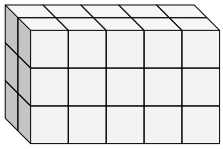

## Réponses

| | | | | |
|---|---|---|---|---|
| Ex. | 3 | 4 | 4 | 48 |
| 1. | | | | |
| 2. | | | | |
| 3. | | | | |
| 4. | | | | |
| 5. | | | | |
| 6. | | | | |
| 7. | | | | |
| 8. | | | | |
| 9. | | | | |



| 1-9 | 89 | 78 | 67 | 56 | 44 | 33 | 22 | 11 | 0 |
|---|---|---|---|---|---|---|---|---|---|

Recherche de volume avec des cubes unitaires Nom: **Clé**

**Trouvez la longueur, la largeur et la hauteur du prisme rectangulaire. Trouvez ensuite le volume.**

**Ex)**

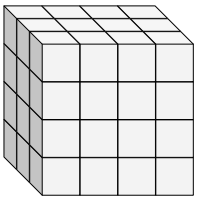

**1)**

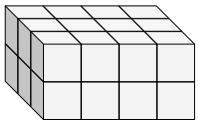

**2)**

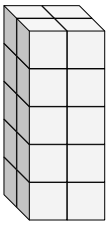

**3)**

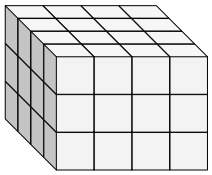

**4)**

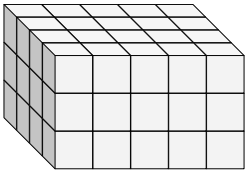

**5)**

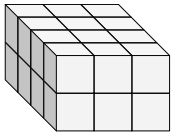

**6)**

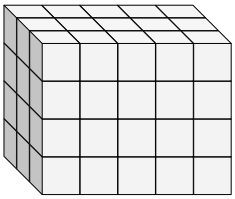

**7)**

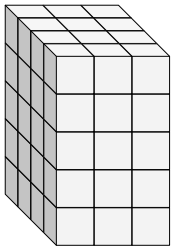

**8)**

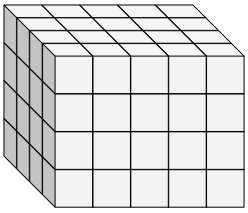

**9)**

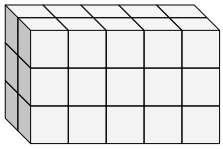

## Réponses

| | | | | |
|---|---|---|---|---|
| Ex. | 3 | 4 | 4 | 48 |
| 1. | 3 | 4 | 2 | 24 |
| 2. | 2 | 2 | 5 | 20 |
| 3. | 4 | 4 | 3 | 48 |
| 4. | 4 | 5 | 3 | 60 |
| 5. | 4 | 3 | 2 | 24 |
| 6. | 3 | 5 | 4 | 60 |
| 7. | 4 | 3 | 5 | 60 |
| 8. | 4 | 5 | 4 | 80 |
| 9. | 2 | 5 | 3 | 30 |



| 1-9 | 89 | 78 | 67 | 56 | 44 | 33 | 22 | 11 | 0 |
|---|---|---|---|---|---|---|---|---|---|