Recherche de volume avec des cubes unitaires Nom:

Trouvez la longueur, la largeur et la hauteur du prisme rectangulaire. Trouvez ensuite le volume.

Ex)

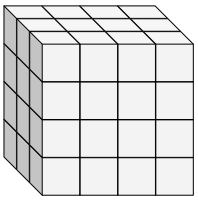

1)

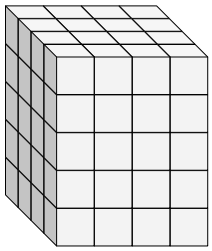

2)

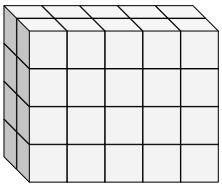

3)

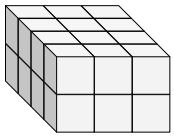

4)

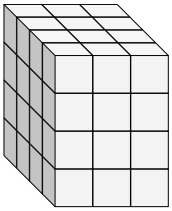

5)

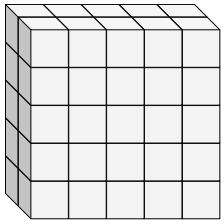

6)

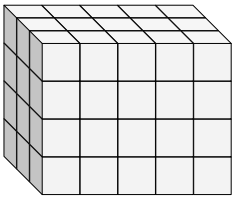

7)

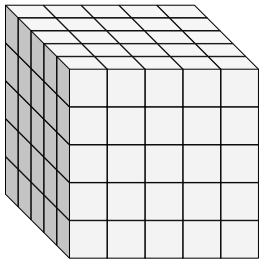

8)

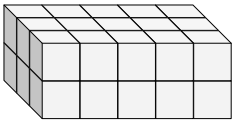

9)

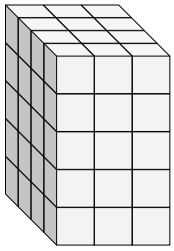

Réponses

Ex.	3	4	4	48
1.				
2.				
3.				
4.				
5.				
6.				
7.				
8.				
9.				

1-9	89	78	67	56	44	33	22	11	0

Recherche de volume avec des cubes unitaires Nom: **Clé**

Trouvez la longueur, la largeur et la hauteur du prisme rectangulaire. Trouvez ensuite le volume.

Ex)

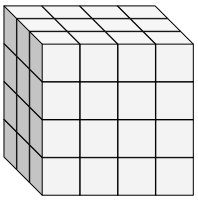

1)

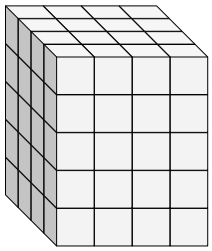

2)

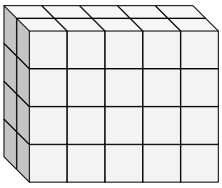

3)

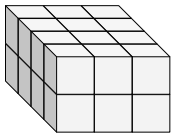

4)

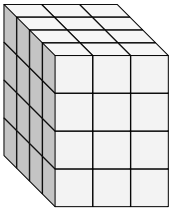

5)

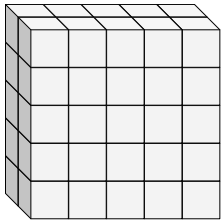

6)

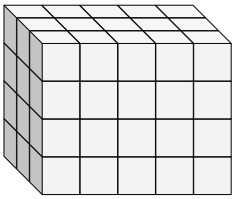

7)

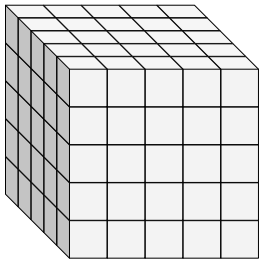

8)

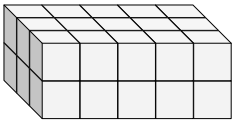

9)

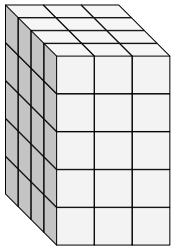

Réponses

Ex.	3	4	4	48
1.	4	4	5	80
2.	2	5	4	40
3.	4	3	2	24
4.	4	3	4	48
5.	2	5	5	50
6.	3	5	4	60
7.	5	5	5	125
8.	3	5	2	30
9.	4	3	5	60

1-9	89	78	67	56	44	33	22	11	0