Identifier le volume d'une boîte Nom:

Déterminez le volume de chaque boîte. Chaque bloc correspond à 1 unité cubique (u 3).

1)

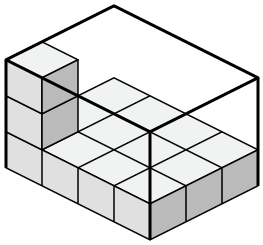

2)

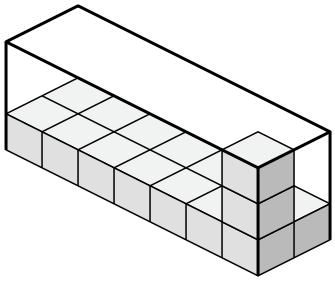

3)

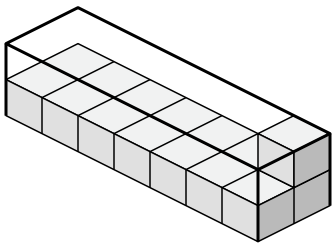

4)

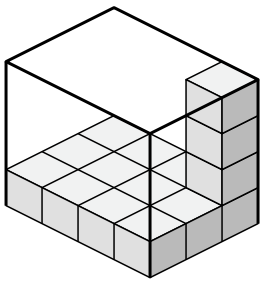

5)

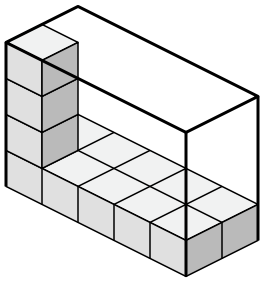

6)

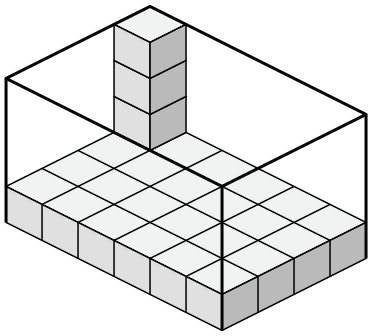

7)

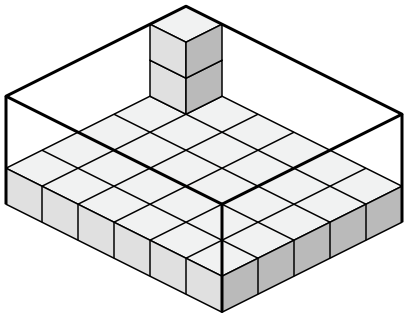

8)

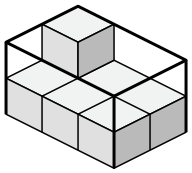

Réponses

1. _____
2. _____
3. _____
4. _____
5. _____
6. _____
7. _____
8. _____

1-8	88	75	63	50	38	25	13	0

Identifier le volume d'une boîte Nom: **Clé**

Déterminez le volume de chaque boîte. Chaque bloc correspond à 1 unité cubique (u 3).

1)

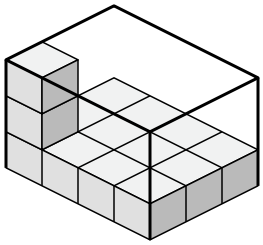

2)

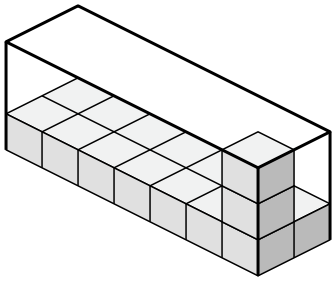

3)

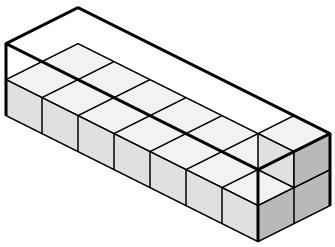

4)

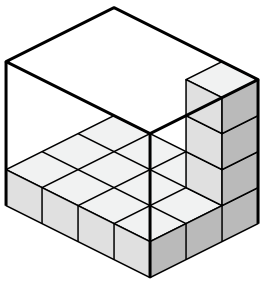

5)

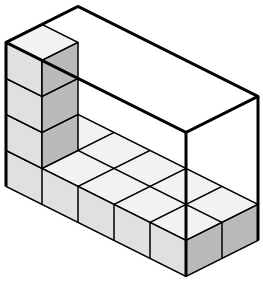

6)

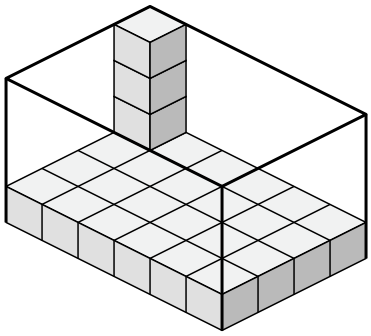

7)

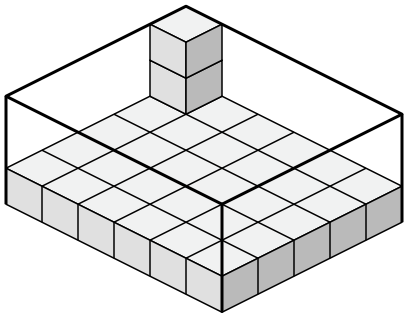

8)

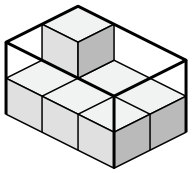

Réponses

1. **36 u^3**
2. **42 u^3**
3. **28 u^3**
4. **48 u^3**
5. **40 u^3**
6. **96 u^3**
7. **90 u^3**
8. **12 u^3**

1-8	88	75	63	50	38	25	13	0