Calculer l'Aire des Grilles avec Bloc

Nom:

Calculez l'aire des zones colorées de chaque grille. Un bloc représente 1 unité carrée (u^2).

1)

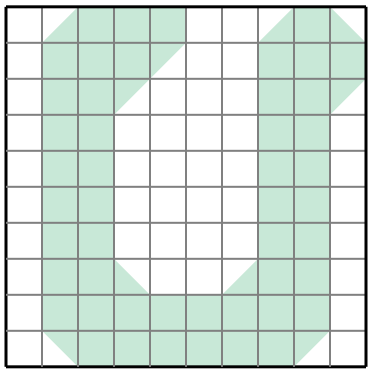

2)

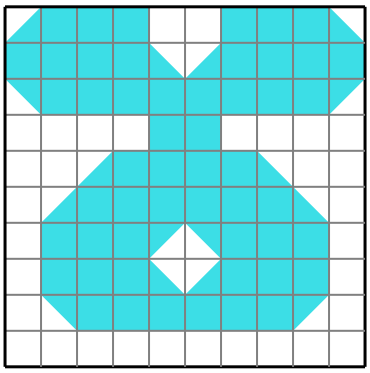

3)

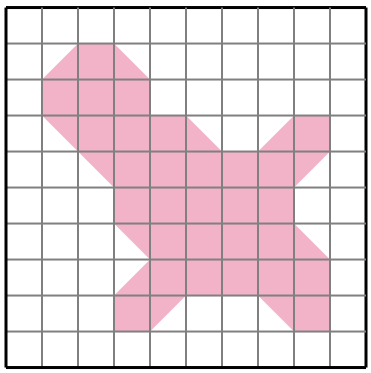

4)

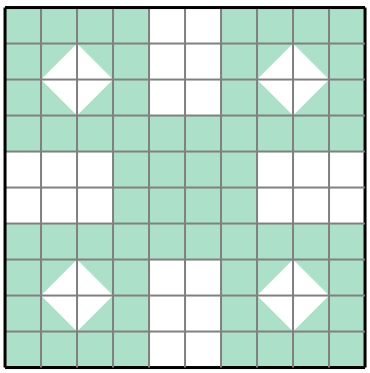

5)

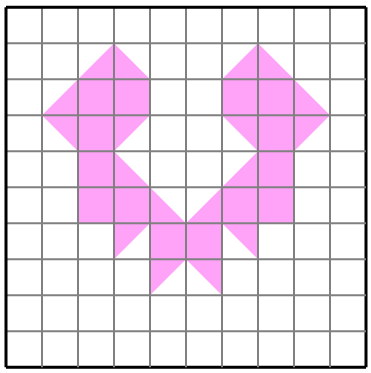

6)

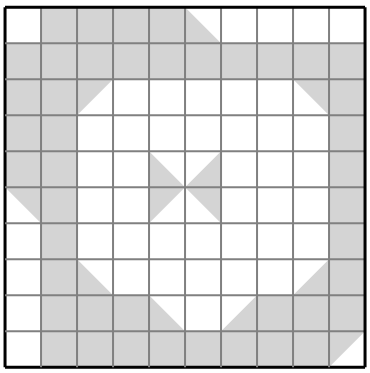

7)

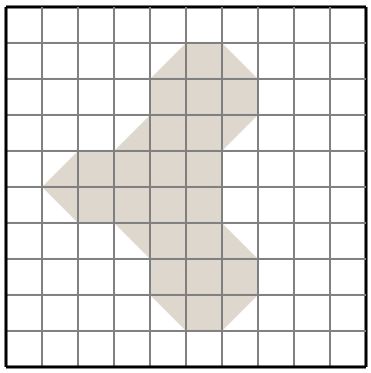

8)

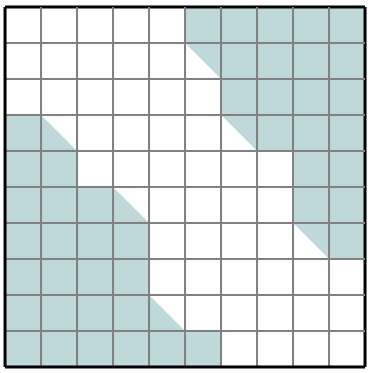

Réponses

1. _____
2. _____
3. _____
4. _____
5. _____
6. _____
7. _____
8. _____

1-8	88	75	63	50	38	25	13	0

Calculer l'Aire des Grilles avec Bloc

Nom: **Clé**

Calculez l'aire des zones colorées de chaque grille. Un bloc représente 1 unité carrée (u^2).

1)

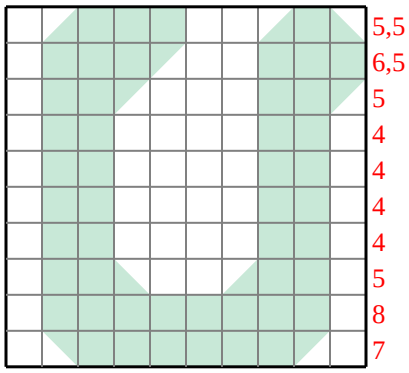

5,5
6,5
5
4
4
4
4
5
8
7

2)

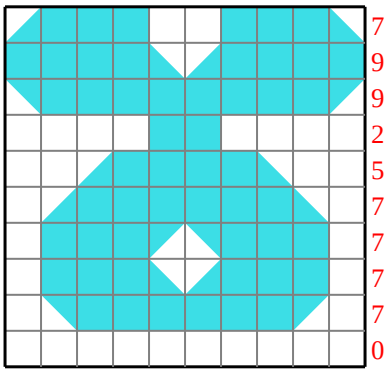

7
9
9
2
5
7
7
7
7
0

3)

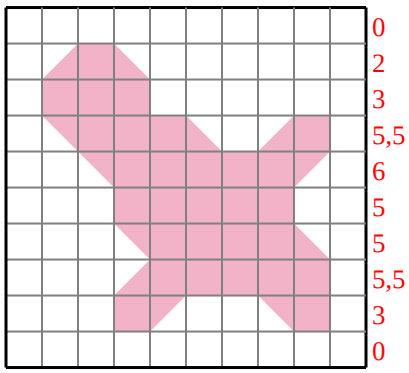

0
2
3
5,5
6
5
5
5,5
3
0

4)

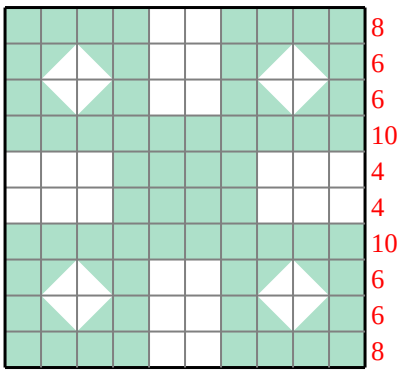

8
6
6
10
4
4
10
6
6
8

5)

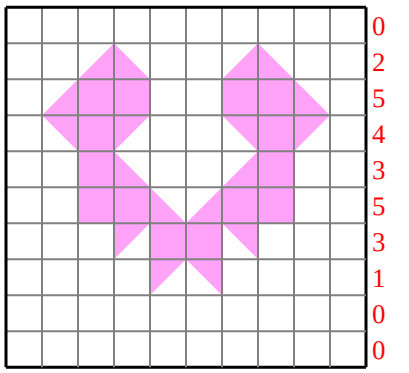

0
2
5
4
3
5
3
1
0
0

6)

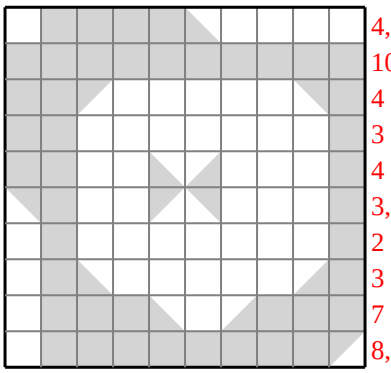

4,5
10
4
3
4
3,5
2
3
7
8,5

7)

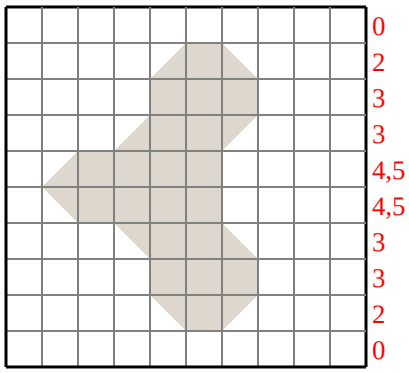

0
2
3
3
4,5
4,5
3
3
2
0

8)

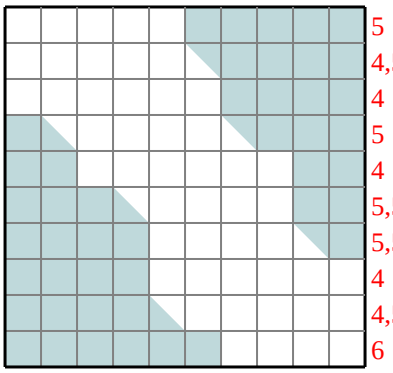

5
4,5
4
5
4
5,5
5,5
4
4,5
6

Réponses

1. **53 u^2**
2. **60 u^2**
3. **35 u^2**
4. **68 u^2**
5. **23 u^2**
6. **49,5 u^2**
7. **25 u^2**
8. **48 u^2**

1-8	88	75	63	50	38	25	13	0