Calcul de l'Aire de Carreaux Nom:

Calculez l'aire du rectangle en le décomposant par carreaux. Comme le premier exercice.

1)

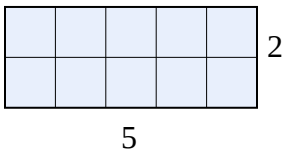

2)

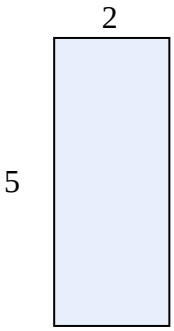

3)

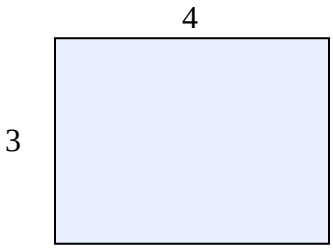

4)

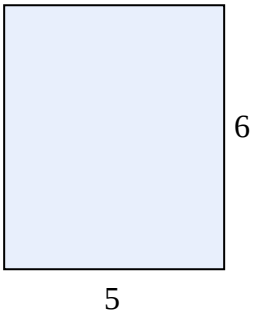

5)

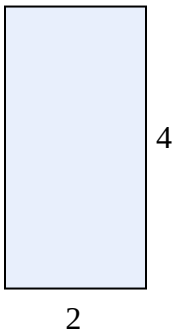

6)

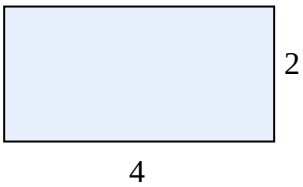

7)

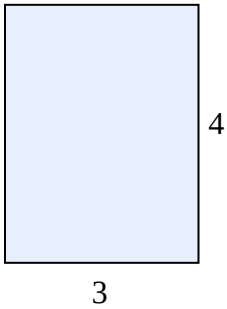

8)

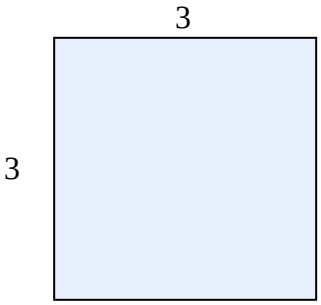

9)

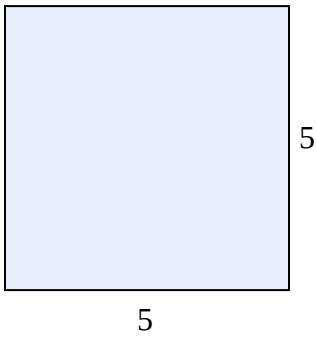

10)

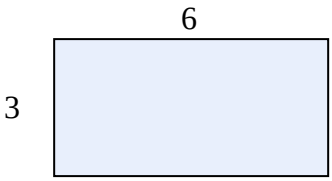

Réponses

1. _____
2. _____
3. _____
4. _____
5. _____
6. _____
7. _____
8. _____
9. _____
10. _____

1-10	90	80	70	60	50	40	30	20	10	0

Calcul de l'Aire de Carreaux Nom: **Clé**

Calculez l'aire du rectangle en le décomposant par carreaux. Comme le premier exercice.

1)

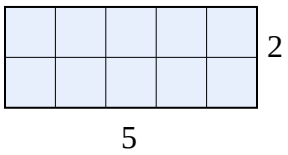

2)

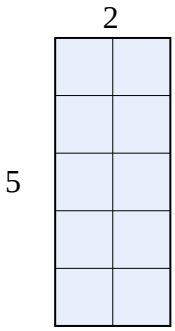

3)

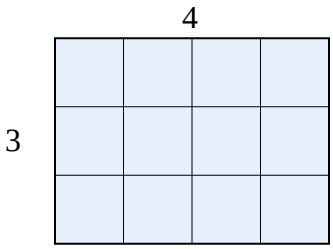

4)

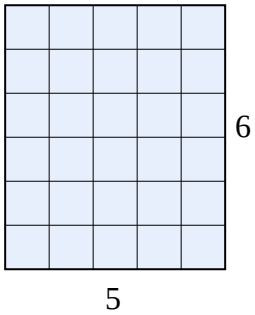

5)

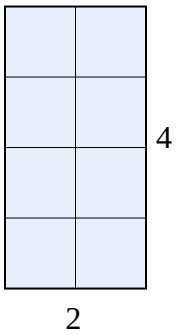

6)

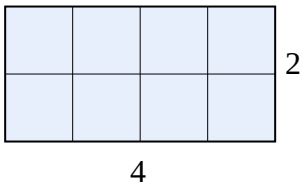

7)

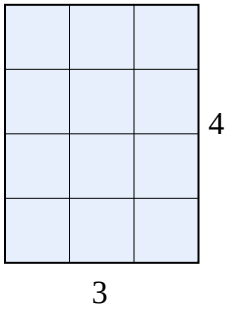

8)

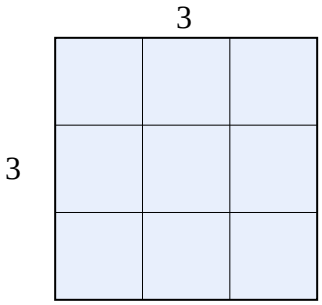

9)

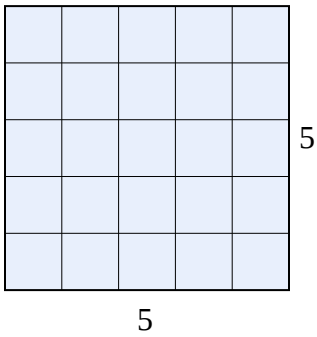

10)

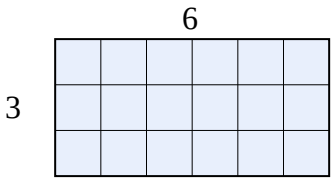

Réponses

1. **10**
2. **10**
3. **12**
4. **30**
5. **8**
6. **8**
7. **12**
8. **9**
9. **25**
10. **18**

1-10	90	80	70	60	50	40	30	20	10	0