Trouver le périmètre et la zone avec des décimales Nom:

Trouvez le périmètre et l'aire de chaque figure. Répondez au dixième près.

1) 4.7 / 3.2

2) 4.41 / 7.66

3) 6.61 / 7.9

4) 4.85 / 6.5

5) 8.5 / 4.66

6) 4.11 / 2.08

7) 5.03 / 6.62

8) 9.9 / 9.59

9) 4.2 / 8.1

10) 5.7 / 3.7

11) 7.2 / 8.2

12) 6.6 / 7.42

13) 3.1 / 9.1

14) 7.6 / 5.9

15) 8.5 / 3.03

Réponses

1. _____ _____
2. _____ _____
3. _____ _____
4. _____ _____
5. _____ _____
6. _____ _____
7. _____ _____
8. _____ _____
9. _____ _____
10. _____ _____
11. _____ _____
12. _____ _____
13. _____ _____
14. _____ _____
15. _____ _____

1-10	93	87	80	73	67	60	53	47	40	33
11-15	27	20	13	7	0					

Trouver le périmètre et la zone avec des décimales Nom: **Clé**

Trouvez le périmètre et l'aire de chaque figure. Répondez au dixième près.

1)

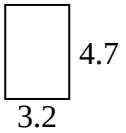

2)

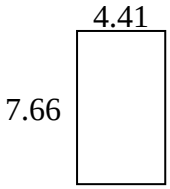

3)

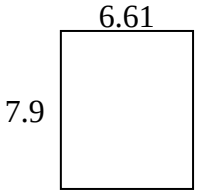

4)

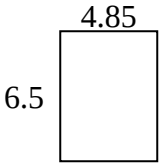

5)

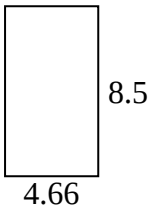

6)

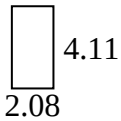

7)

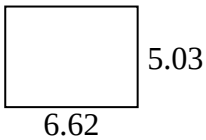

8)

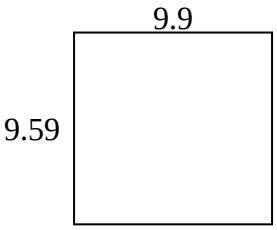

9)

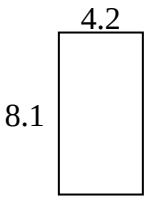

10)

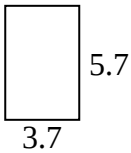

11)

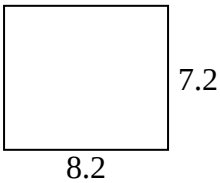

12)

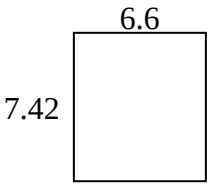

13)



14)

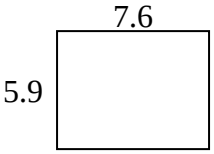

15)



Réponses

1.	15,0	15,8
2.	33,8	24,1
3.	52,2	29,0
4.	31,5	22,7
5.	39,6	26,3
6.	8,5	12,4
7.	33,3	23,3
8.	94,9	39,0
9.	34,0	24,6
10.	21,1	18,8
11.	59,0	30,8
12.	49,0	28,0
13.	28,2	24,4
14.	44,8	27,0
15.	25,8	23,1

1-10	93	87	80	73	67	60	53	47	40	33
11-15	27	20	13	7	0					