Calcul d'un Côté Manquant (Grâce au Périmètre)

Nom:

Déterminez la valeur de 'L'. Les données sont en cm.

1) Périmètre = 26

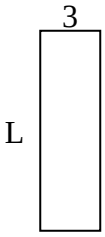

2) Périmètre = 22

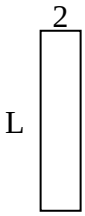

3) Périmètre = 12

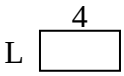

4) Périmètre = 26

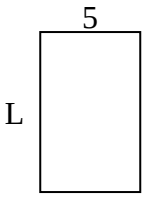

5) Périmètre = 30

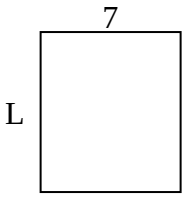

6) Périmètre = 32

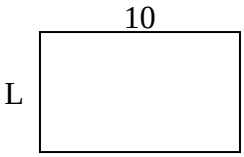

7) Périmètre = 24

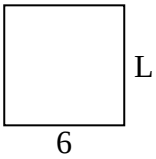

8) Périmètre = 24

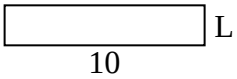

9) Périmètre = 28

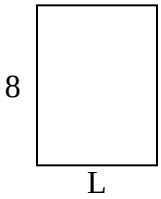

10) Périmètre = 12

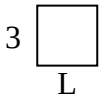

11) Périmètre = 26

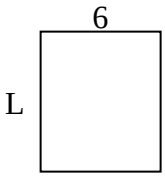

12) Périmètre = 26

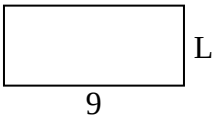

13) Périmètre = 20

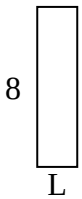

14) Périmètre = 14

15) Périmètre = 38

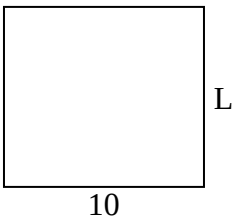

Réponses

1. _____
2. _____
3. _____
4. _____
5. _____
6. _____
7. _____
8. _____
9. _____
10. _____
11. _____
12. _____
13. _____
14. _____
15. _____

1-10	93	87	80	73	67	60	53	47	40	33
11-15	27	20	13	7	0					

Calcul d'un Côté Manquant (Grâce au Périmètre)

Nom: **Clé**

Déterminez la valeur de 'L'. Les données sont en cm.

1) Périmètre = 26

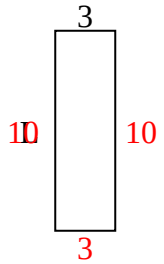

2) Périmètre = 22

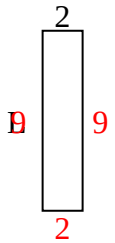

3) Périmètre = 12

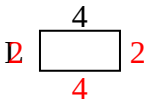

4) Périmètre = 26

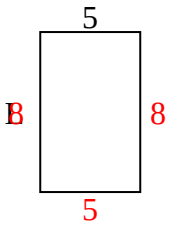

5) Périmètre = 30

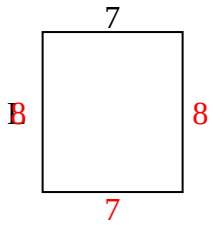

6) Périmètre = 32

7) Périmètre = 24

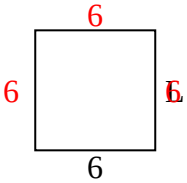

8) Périmètre = 24

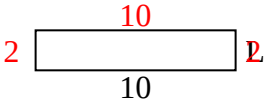

9) Périmètre = 28

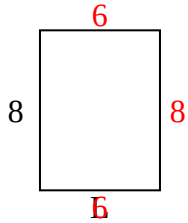

10) Périmètre = 12

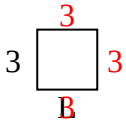

11) Périmètre = 26

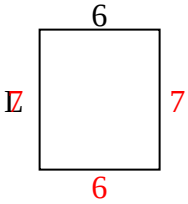

12) Périmètre = 26

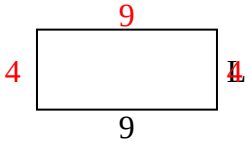

13) Périmètre = 20

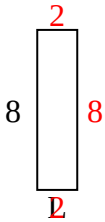

14) Périmètre = 14

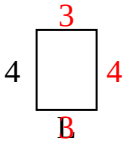

15) Périmètre = 38

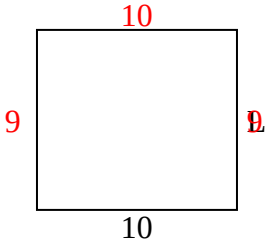

Réponses

1. **10 cm**
2. **9 cm**
3. **2 cm**
4. **8 cm**
5. **8 cm**
6. **6 cm**
7. **6 cm**
8. **2 cm**
9. **6 cm**
10. **3 cm**
11. **7 cm**
12. **4 cm**
13. **2 cm**
14. **3 cm**
15. **9 cm**

1-10	93	87	80	73	67	60	53	47	40	33
11-15	27	20	13	7	0					