Calcul d'un Côté Manquant (Grâce au Périmètre)

Nom:

Déterminez la valeur de 'L'. Les données sont en cm.

1) Périmètre = 12

2) Périmètre = 26

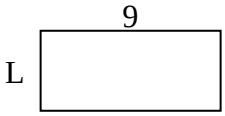

3) Périmètre = 18

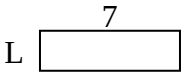

4) Périmètre = 32

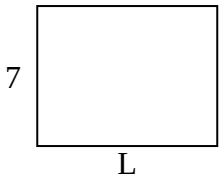

5) Périmètre = 12

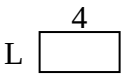

6) Périmètre = 32

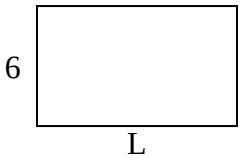

7) Périmètre = 28

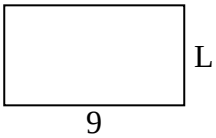

8) Périmètre = 24

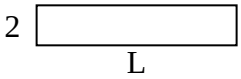

9) Périmètre = 26

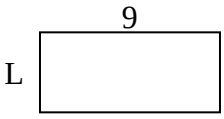

10) Périmètre = 28

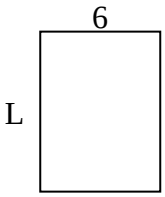

11) Périmètre = 16

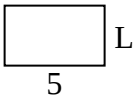

12) Périmètre = 32

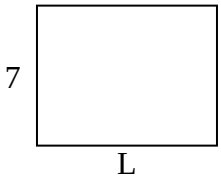

13) Périmètre = 24

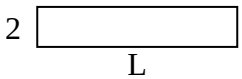

14) Périmètre = 22

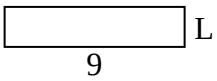

15) Périmètre = 26



Réponses

1. _____
2. _____
3. _____
4. _____
5. _____
6. _____
7. _____
8. _____
9. _____
10. _____
11. _____
12. _____
13. _____
14. _____
15. _____

1-10	93	87	80	73	67	60	53	47	40	33
11-15	27	20	13	7	0					

Calcul d'un Côté Manquant (Grâce au Périmètre) Nom: **Clé**

Déterminez la valeur de 'L'. Les données sont en cm.

1) Périmètre = 12

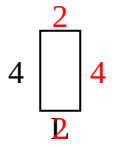

2) Périmètre = 26

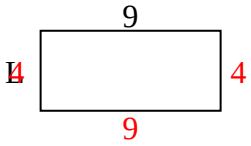

3) Périmètre = 18

4) Périmètre = 32

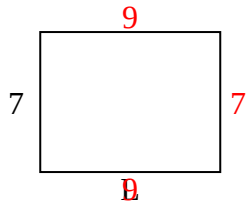

5) Périmètre = 12

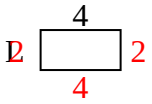

6) Périmètre = 32

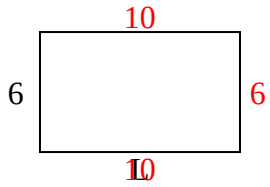

7) Périmètre = 28

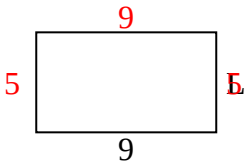

8) Périmètre = 24

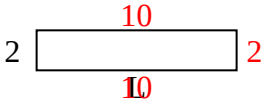

9) Périmètre = 26

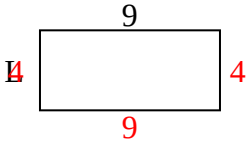

10) Périmètre = 28

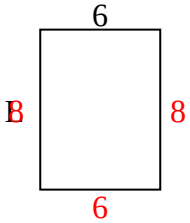

11) Périmètre = 16

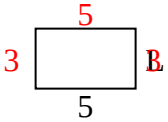

12) Périmètre = 32

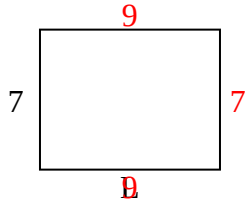

13) Périmètre = 24

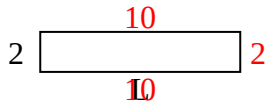

14) Périmètre = 22

15) Périmètre = 26

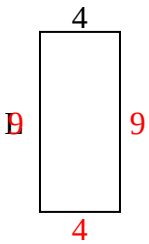

Réponses

1. **2 cm**
2. **4 cm**
3. **2 cm**
4. **9 cm**
5. **2 cm**
6. **10 cm**
7. **5 cm**
8. **10 cm**
9. **4 cm**
10. **8 cm**
11. **3 cm**
12. **9 cm**
13. **10 cm**
14. **2 cm**
15. **9 cm**

1-10	93	87	80	73	67	60	53	47	40	33
11-15	27	20	13	7	0					