Équilibrer les Équations

Nom:

Ces Balances ne sont pas équilibrées. Déterminez quel nombre permettra l'équilibre.

1)

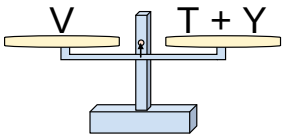

A. T = Y - V
B. T = V - Y
C. T = Y + V
D. T = V + Y

2)

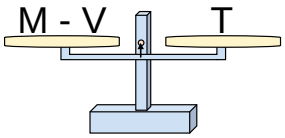

A. M = T + T
B. M = T - V
C. M = V + T
D. M = V - T

3)

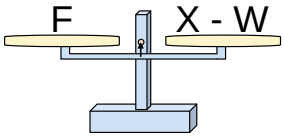

A. X = W - F
B. X = W + F
C. X = F - W
D. X = F + F

4)

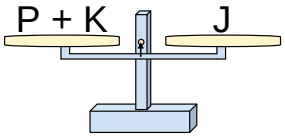

A. P = K - J
B. P = K + J
C. P = J + K
D. P = J - K

5)

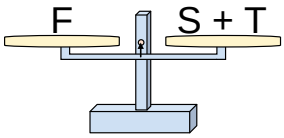

A. S = F - T
B. S = T - F
C. S = T + F
D. S = F + T

6)

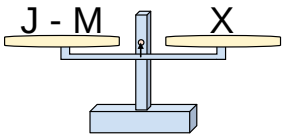

A. J = M + X
B. J = X + X
C. J = M - X
D. J = X - M

7)

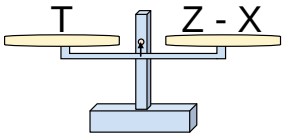

A. Z = T + T
B. Z = T - X
C. Z = X + T
D. Z = X - T

8)

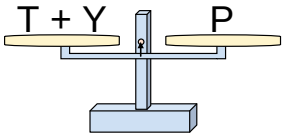

A. T = Y - P
B. T = Y + P
C. T = P + Y
D. T = P - Y

Réponses

1. _____
2. _____
3. _____
4. _____
5. _____
6. _____
7. _____
8. _____

1-8	88	75	63	50	38	25	13	0

Équilibrer les Équations Nom: **Clé**

Ces Balances ne sont pas équilibrées. Déterminez quel nombre permettra l'équilibre.

1)

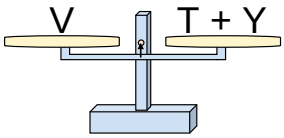

A. T = Y - V
B. T = V - Y
C. T = Y + V
D. T = V + Y

2)

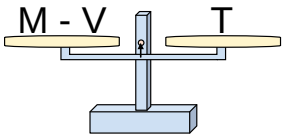

A. M = T + T
B. M = T - V
C. M = V + T
D. M = V - T

3)

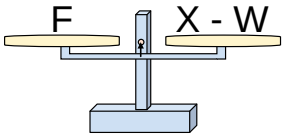

A. X = W - F
B. X = W + F
C. X = F - W
D. X = F + F

4)

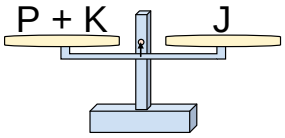

A. P = K - J
B. P = K + J
C. P = J + K
D. P = J - K

5)

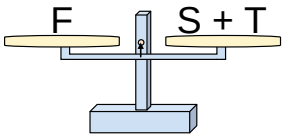

A. S = F - T
B. S = T - F
C. S = T + F
D. S = F + T

6)

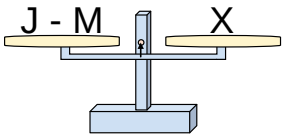

A. J = M + X
B. J = X + X
C. J = M - X
D. J = X - M

7)

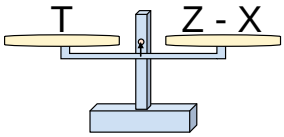

A. Z = T + T
B. Z = T - X
C. Z = X + T
D. Z = X - T

8)

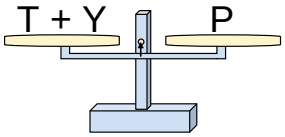

A. T = Y - P
B. T = Y + P
C. T = P + Y
D. T = P - Y

Réponses

1. **B**
2. **C**
3. **B**
4. **D**
5. **A**
6. **A**
7. **C**
8. **D**

1-8	88	75	63	50	38	25	13	0