Compter les formes

Nom:

Comptez le nombre de formes affichées.

1)

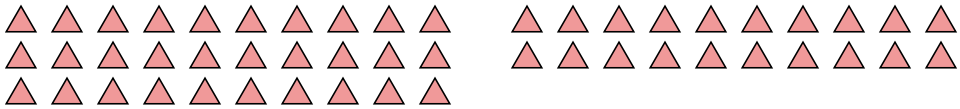

2)

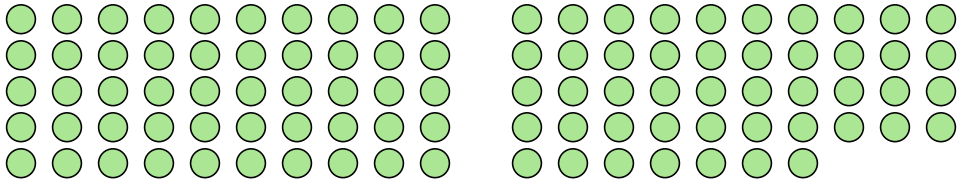

3)

4)

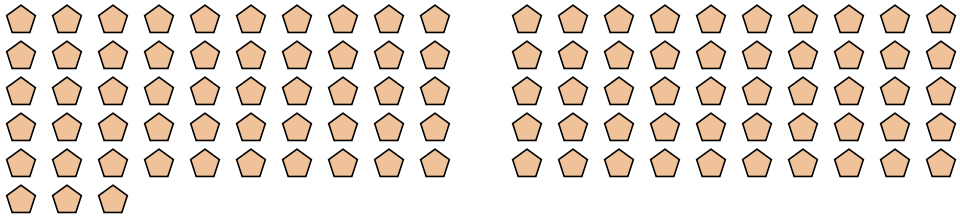

5)

Réponses

1. _____

2. _____

3. _____

4. _____

5. _____

1-5	80	60	40	20	0

Compter les formes

Nom: **Clé**

Comptez le nombre de formes affichées.

1) 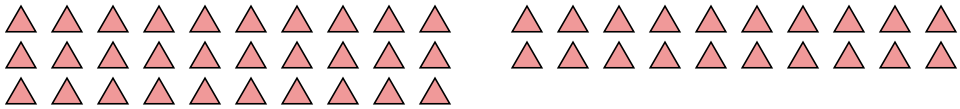

2) 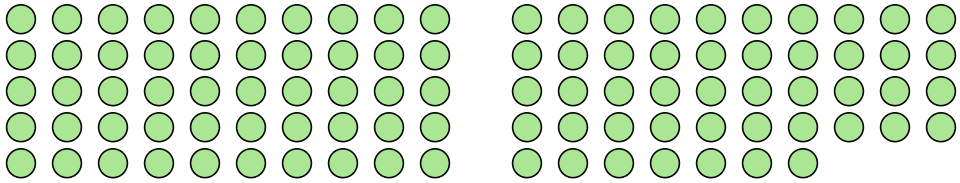

3)

4) 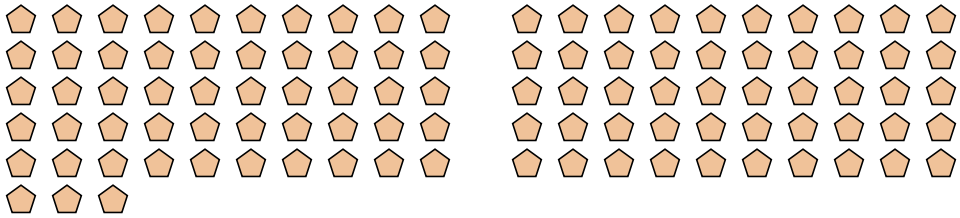

5)

Réponses

1. **50**
2. **97**
3. **27**
4. **103**
5. **64**

1-5	80	60	40	20	0