Compter les formes

Nom:

Comptez le nombre de formes affichées.

1)



2)

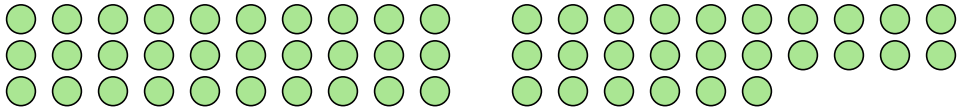

3)

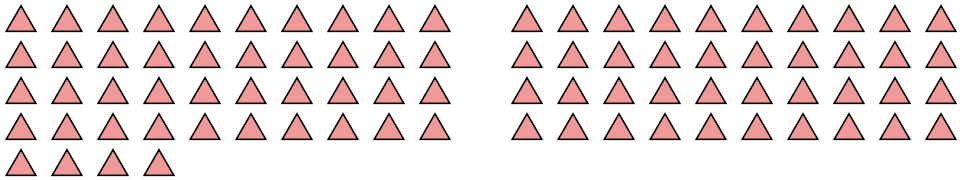

4)

5)

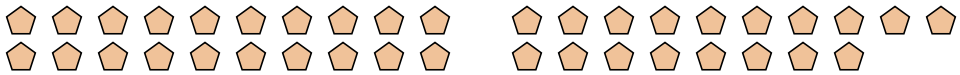

Réponses

1. _____

2. _____

3. _____

4. _____

5. _____

1-5	80	60	40	20	0

Compter les formes

Nom: **Clé**

Comptez le nombre de formes affichées.

1) 

2) 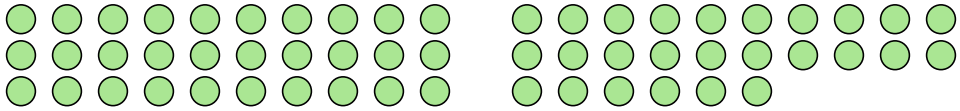

3) 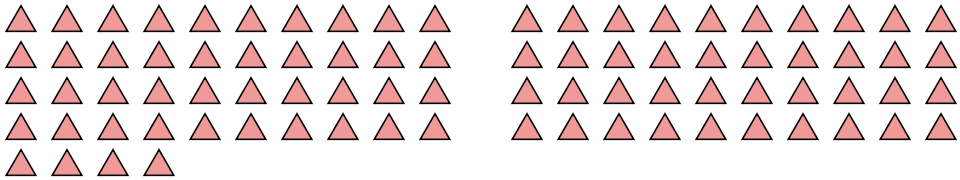

4)

5) 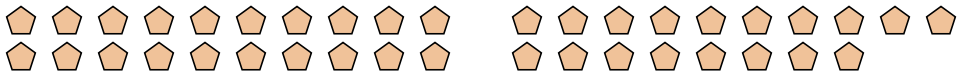

Réponses

1. **73**
2. **56**
3. **84**
4. **103**
5. **38**

1-5	80	60	40	20	0

Compter les formes

Nom:

Comptez le nombre de formes affichées.

1)

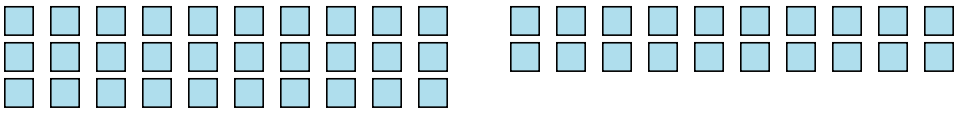

2)

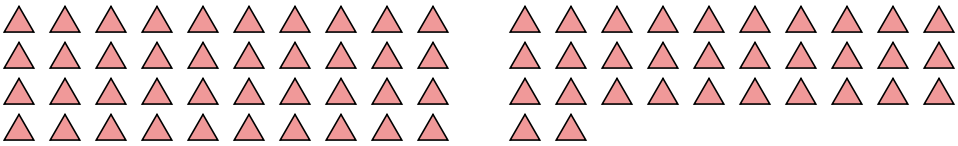

3)

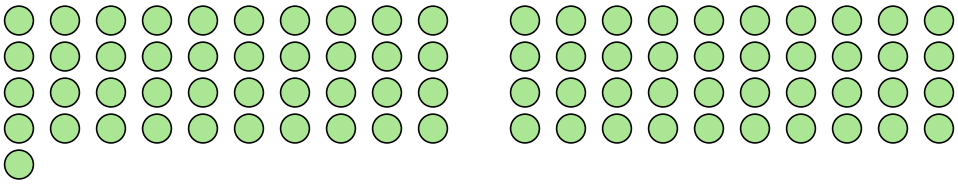

4)

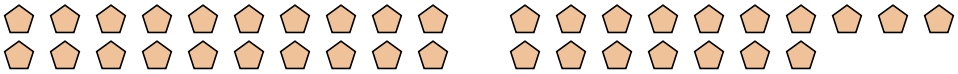

5)

Réponses

1. _____

2. _____

3. _____

4. _____

5. _____

1-5	80	60	40	20	0

Compter les formes

Nom: **Clé**

Comptez le nombre de formes affichées.

1) 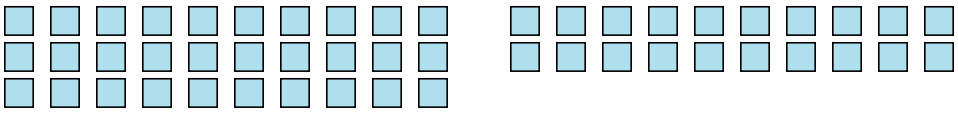

2) 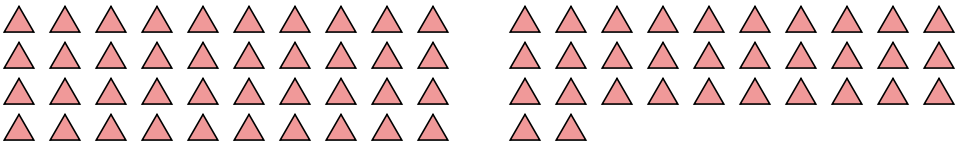

3) 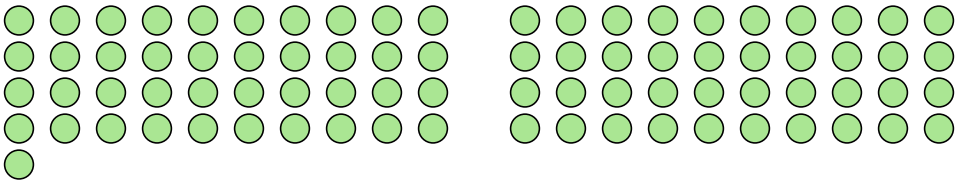

4) 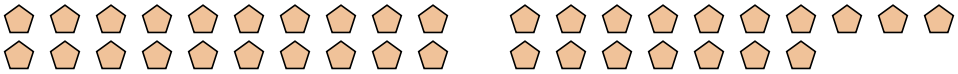

5)

Réponses

1. **50**
2. **72**
3. **81**
4. **37**
5. **17**

1-5	80	60	40	20	0

Compter les formes

Nom:

Comptez le nombre de formes affichées.

1)

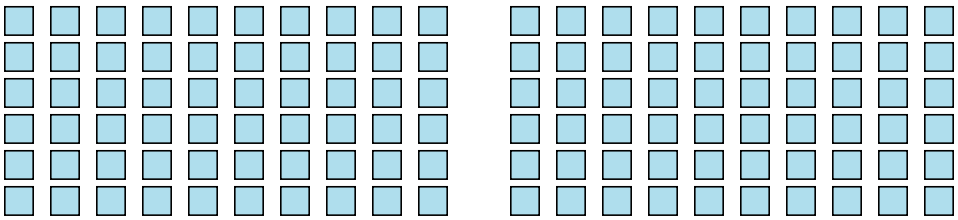

2)

3)

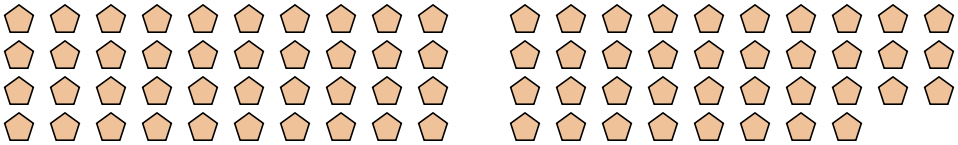

4)

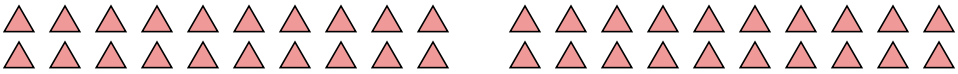

5)



Réponses

1. _____
2. _____
3. _____
4. _____
5. _____

1-5	80	60	40	20	0

Compter les formes

Nom: **Clé**

Comptez le nombre de formes affichées.

1) 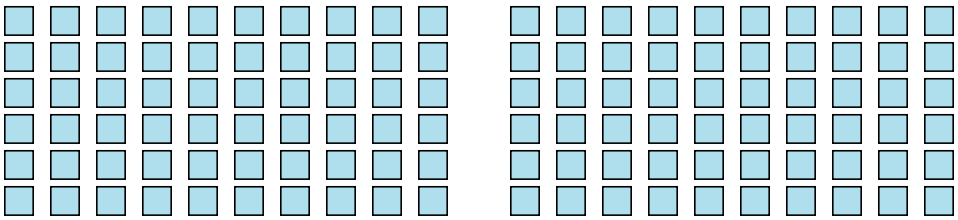

2)

3) 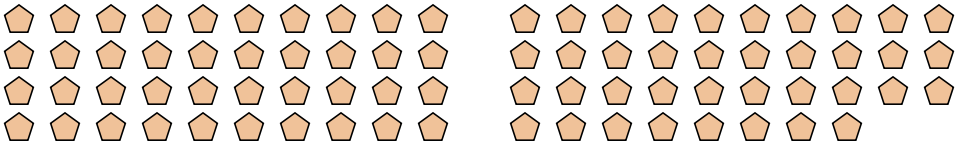

4) 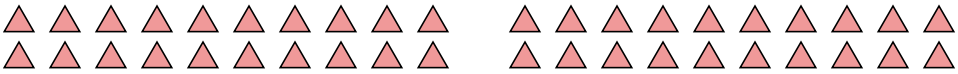

5) 

Réponses

1. **120**
2. **59**
3. **78**
4. **40**
5. **91**

1-5	80	60	40	20	0

Compter les formes

Nom:

Comptez le nombre de formes affichées.

1)

2)

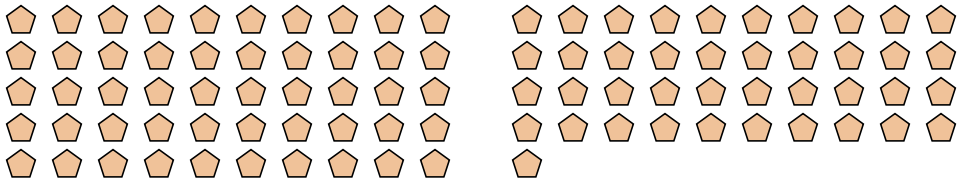

3)

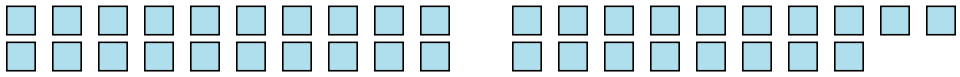

4)

5)

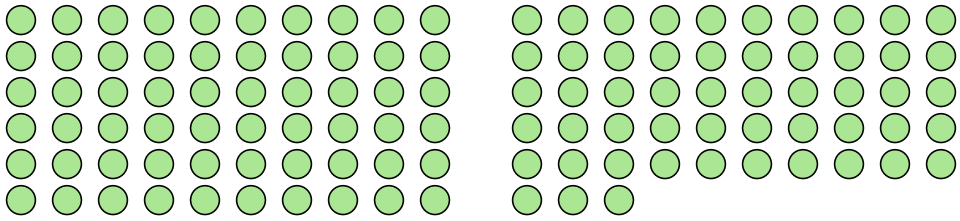

Réponses

1. _____

2. _____

3. _____

4. _____

5. _____

1-5	80	60	40	20	0

Compter les formes

Nom: **Clé**

Comptez le nombre de formes affichées.

1)

2) 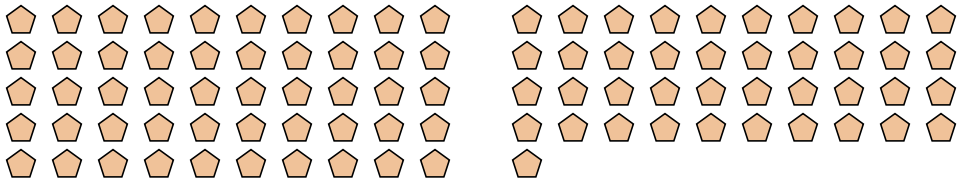

3) 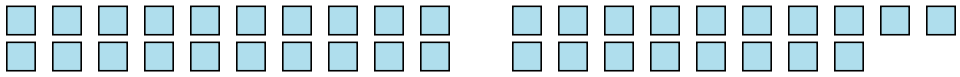

4)

5) 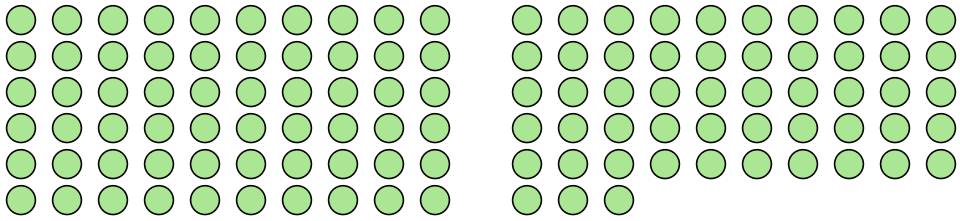

Réponses

1. **51**
2. **91**
3. **38**
4. **8**
5. **113**

1-5	80	60	40	20	0

Compter les formes

Nom:

Comptez le nombre de formes affichées.

1)

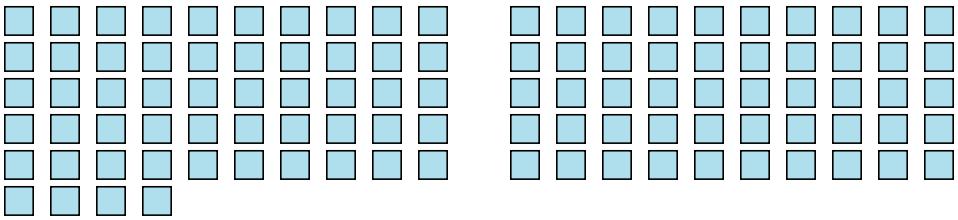

2)

3)

4)

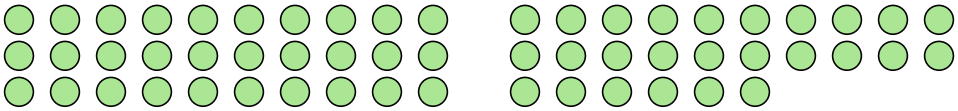

5)

Réponses

1. _____
2. _____
3. _____
4. _____
5. _____

1-5	80	60	40	20	0

Compter les formes

Nom: **Clé**

Comptez le nombre de formes affichées.

1) 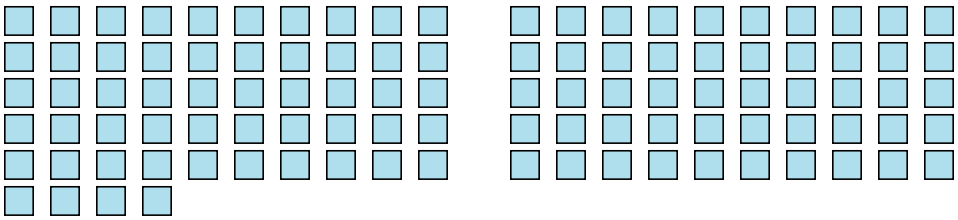

2)

3)

4) 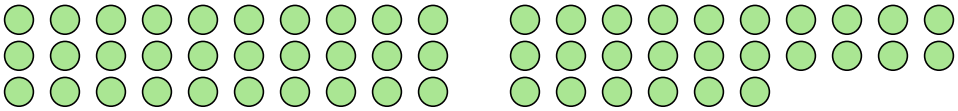

5)

Réponses

1. **104**
2. **69**
3. **17**
4. **56**
5. **25**

1-5	80	60	40	20	0

Compter les formes

Nom:

Comptez le nombre de formes affichées.

1)

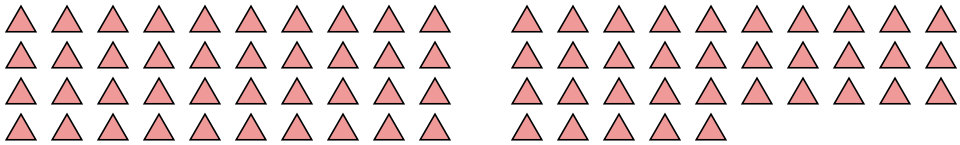

2)

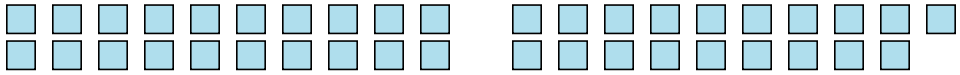

3)

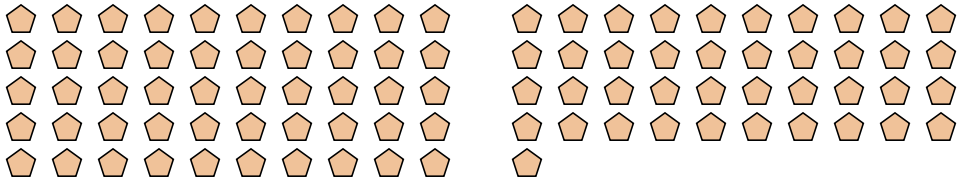

4)

5)

Réponses

1. _____
2. _____
3. _____
4. _____
5. _____

1-5	80	60	40	20	0

Compter les formes

Nom: **Clé**

Comptez le nombre de formes affichées.

1) 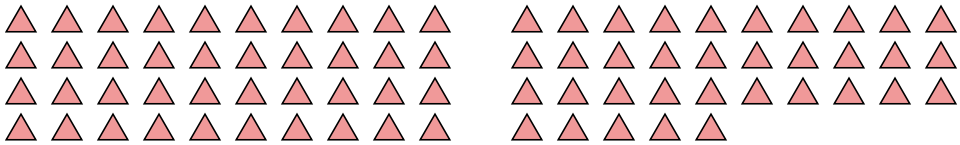

2) 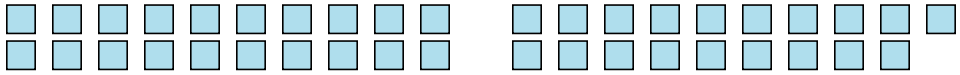

3) 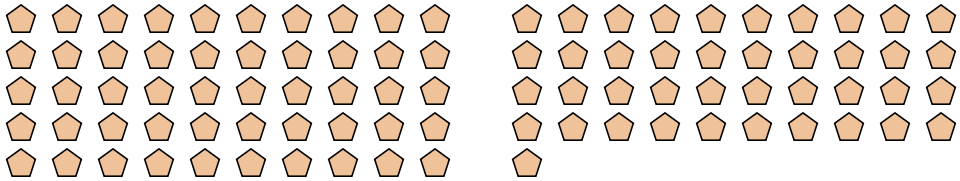

4)

5)

Réponses

1. **75**
2. **39**
3. **91**
4. **15**
5. **106**

1-5	80	60	40	20	0

Compter les formes

Nom:

Comptez le nombre de formes affichées.

1)

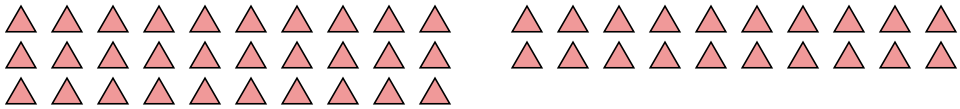

2)

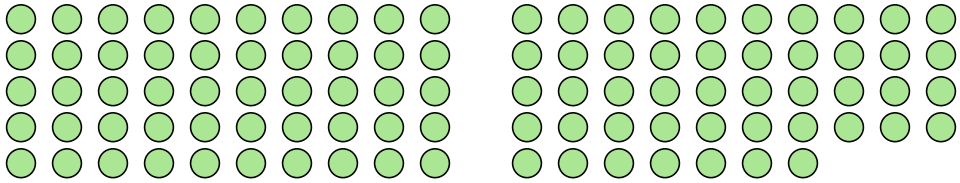

3)

4)

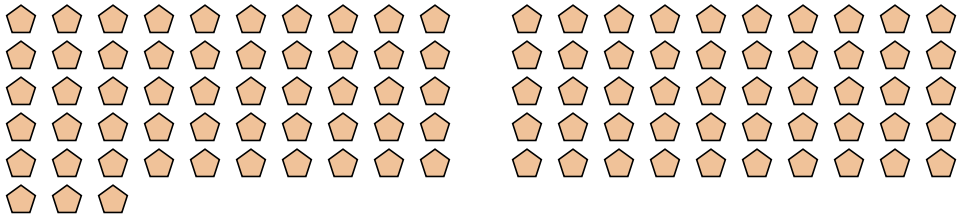

5)

Réponses

1. _____

2. _____

3. _____

4. _____

5. _____

1-5	80	60	40	20	0

Compter les formes

Nom: **Clé**

Comptez le nombre de formes affichées.

1) 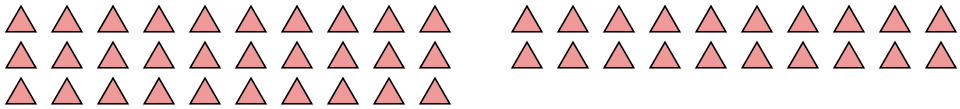

2) 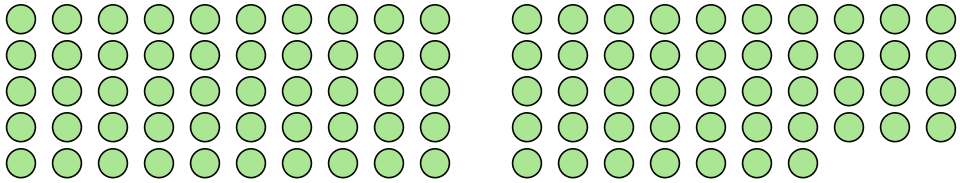

3)

4) 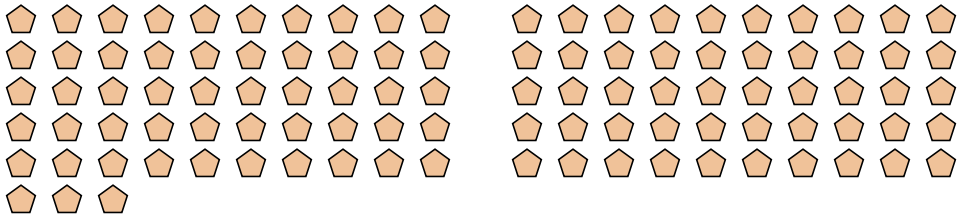

5)

Réponses

1. **50**
2. **97**
3. **27**
4. **103**
5. **64**

1-5	80	60	40	20	0

Compter les formes

Nom:

Comptez le nombre de formes affichées.

1)



2)

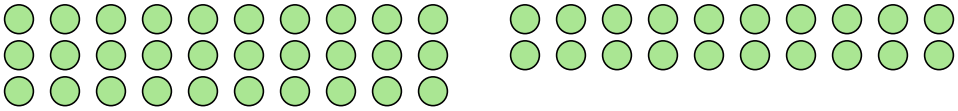

3)

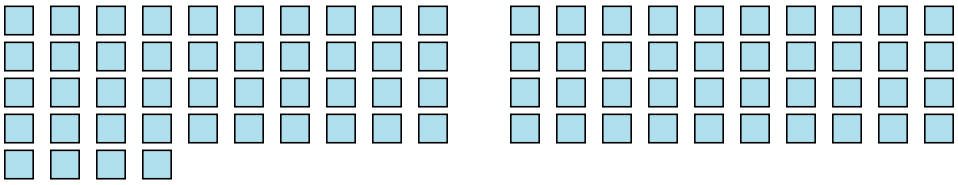

4)

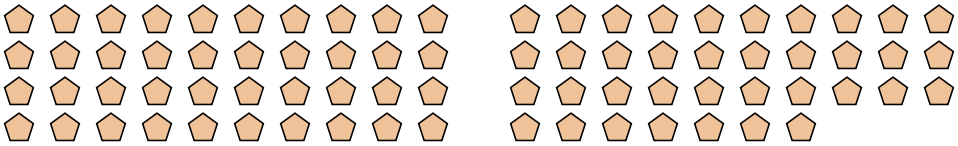

5)

Réponses

1. _____
2. _____
3. _____
4. _____
5. _____

1-5	80	60	40	20	0

Compter les formes

Nom: **Clé**

Comptez le nombre de formes affichées.

1) 

2) 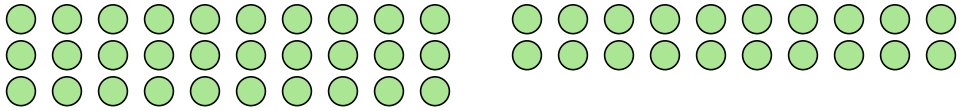

3) 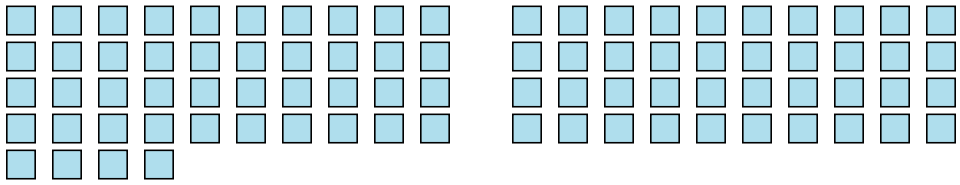

4) 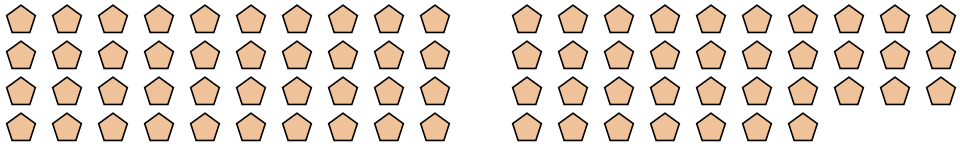

5)

Réponses

1. **108**
2. **50**
3. **84**
4. **77**
5. **31**

1-5	80	60	40	20	0

Compter les formes

Nom:

Comptez le nombre de formes affichées.

1)

2)

3) 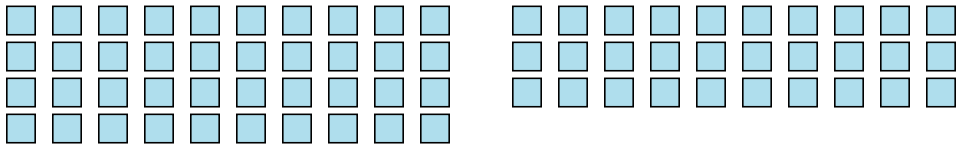

4)

5) 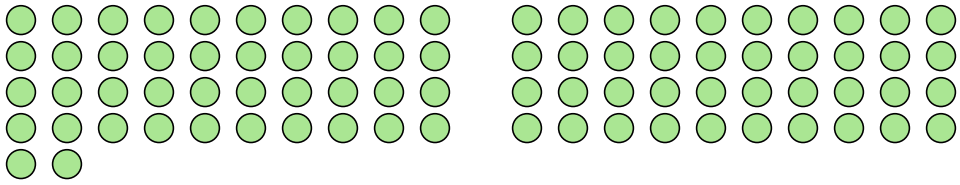

Réponses

1. _____
2. _____
3. _____
4. _____
5. _____

1-5	80	60	40	20	0

Compter les formes

Nom: **Clé**

Comptez le nombre de formes affichées.

1)

2)

3) 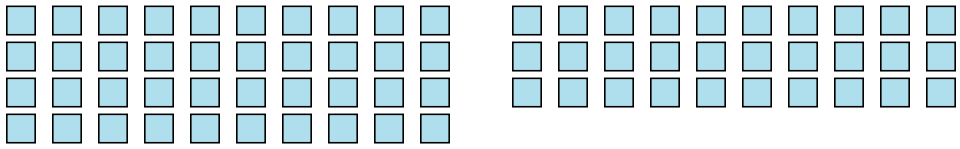

4)

5) 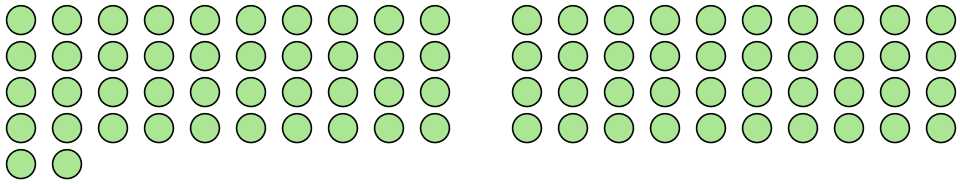

Réponses

1. **52**
2. **7**
3. **70**
4. **22**
5. **82**

1-5	80	60	40	20	0

Compter les formes

Nom:

Comptez le nombre de formes affichées.

1) 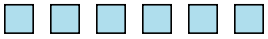

2)

3)

4) 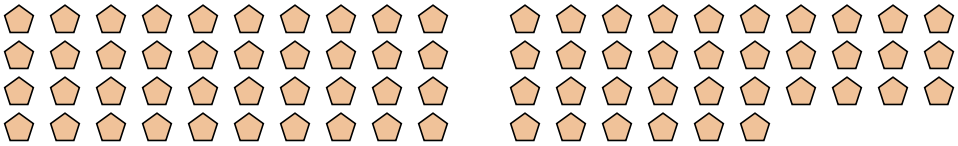

5) 

Réponses

1. _____
2. _____
3. _____
4. _____
5. _____

1-5	80	60	40	20	0

Compter les formes

Nom: **Clé**

Comptez le nombre de formes affichées.

1) 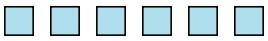

2)

3)

4) 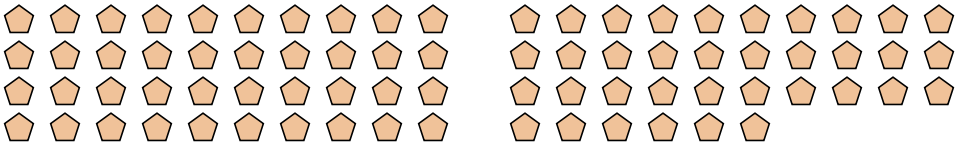

5) 

Réponses

1. **6**
2. **51**
3. **31**
4. **76**
5. **103**

1-5	80	60	40	20	0