Détermination de la valeur décimale avec des blocs

Nom:

Utilisez le bloc de gauche pour trouver la valeur de l'ensemble de blocs de droite.

1) 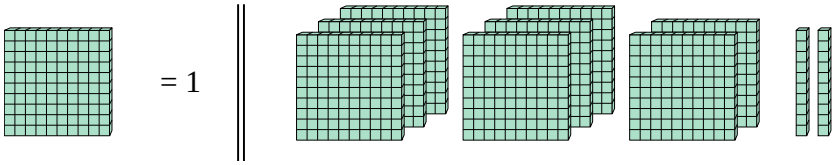

2) 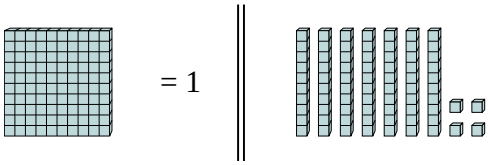

3) 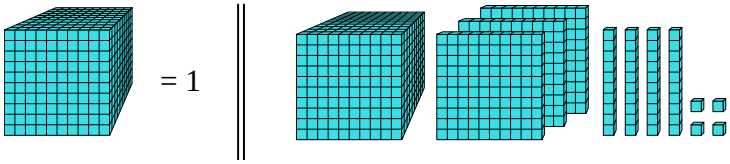

4) 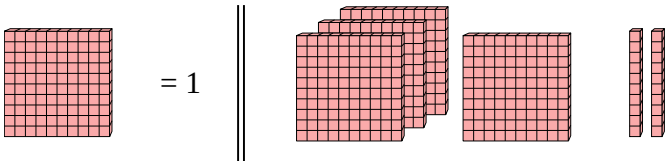

5) 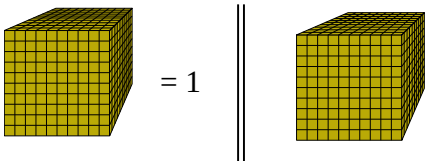

6) 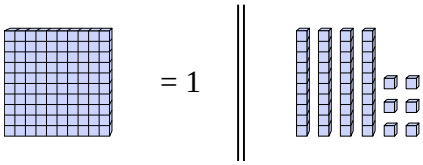

7) 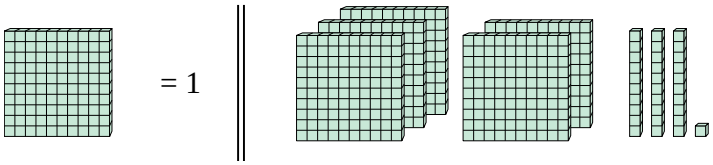

8) 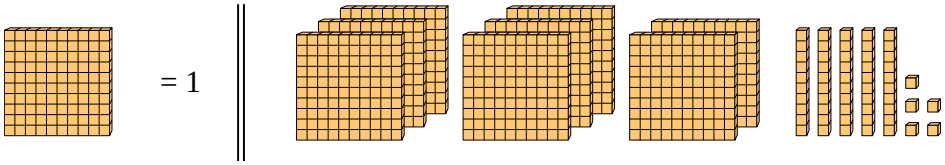

9) 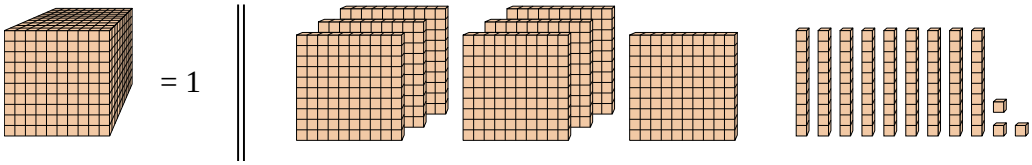

10) 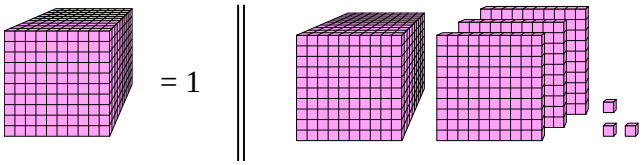

Réponses

1. _____
2. _____
3. _____
4. _____
5. _____
6. _____
7. _____
8. _____
9. _____
10. _____

1-10	90	80	70	60	50	40	30	20	10	0

Détermination de la valeur décimale avec des blocs Nom: **Clé**

Utilisez le bloc de gauche pour trouver la valeur de l'ensemble de blocs de droite.

1) 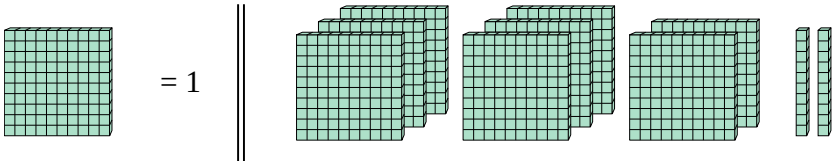

2) 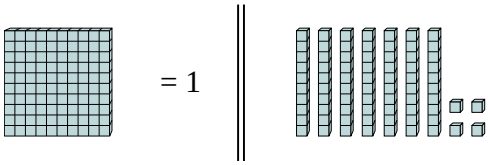

3) 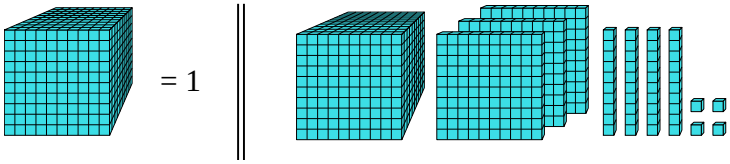

4) 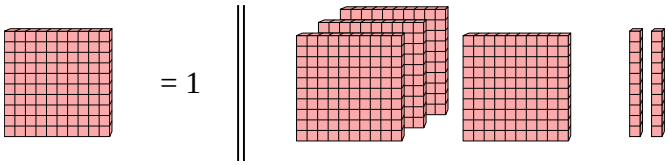

5) 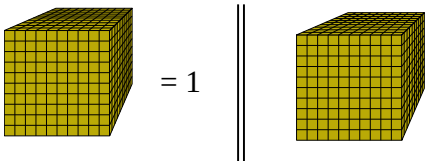

6) 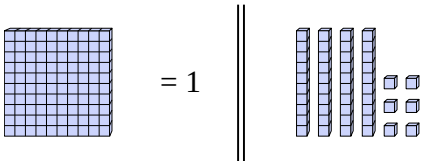

7) 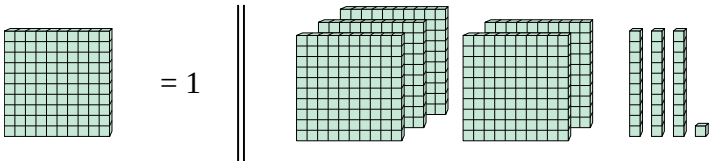

8) 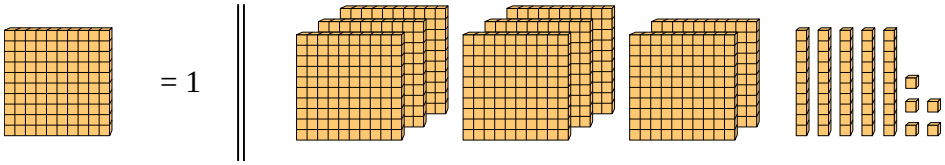

9) 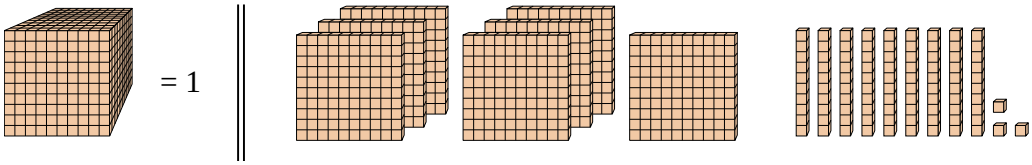

10) 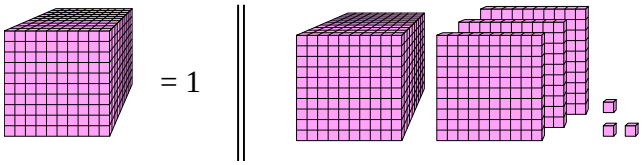

Réponses

1. **8,2**
2. **0,74**
3. **1,344**
4. **4,2**
5. **1**
6. **0,46**
7. **5,31**
8. **8,55**
9. **0,793**
10. **1,303**

1-10	90	80	70	60	50	40	30	20	10	0