Multiplications de Nombres Décimaux (Visuelle)

Nom:

Utilisez la méthode visuelle pour résoudre chaque exercice.

1) 3 × 0,7 =

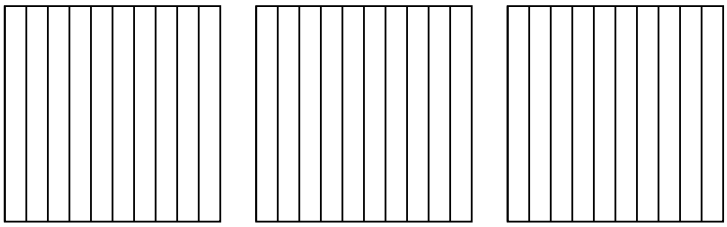

2) 2 × 0,68 =

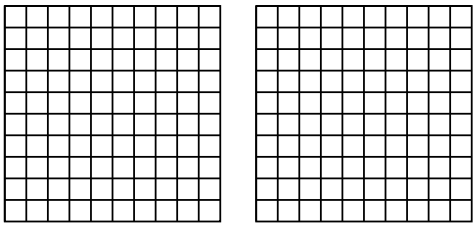

3) 2 × 0,4 =

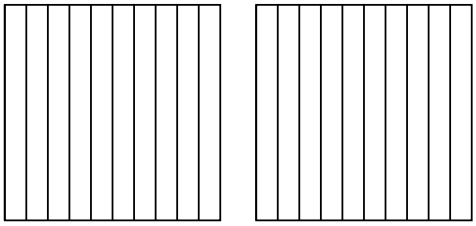

4) 2 × 0,81 =

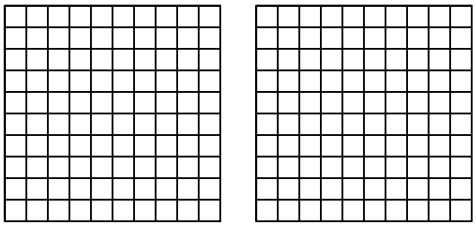

5) 2 × 0,25 =

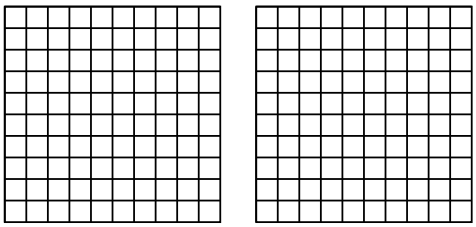

6) 4 × 0,8 =

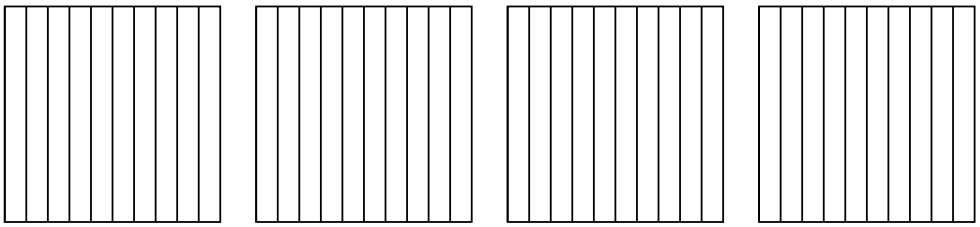

Réponses

1. _____
2. _____
3. _____
4. _____
5. _____
6. _____

1-6	83	67	50	33	17	0

Multiplications de Nombres Décimaux (Visuelle) Nom: **Clé**

Utilisez la méthode visuelle pour résoudre chaque exercice.

1) 3 × 0,7 =

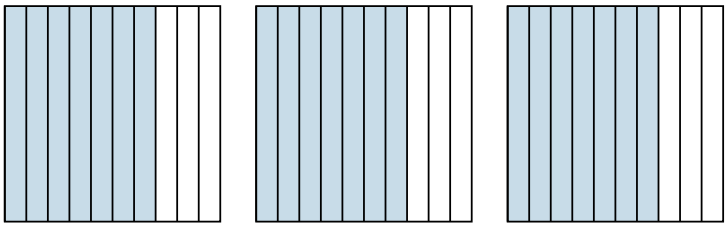

2) 2 × 0,68 =

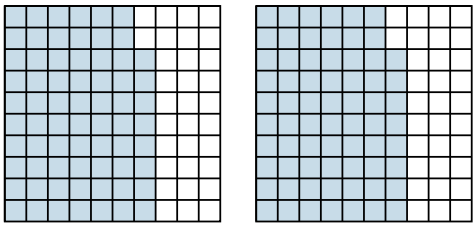

3) 2 × 0,4 =

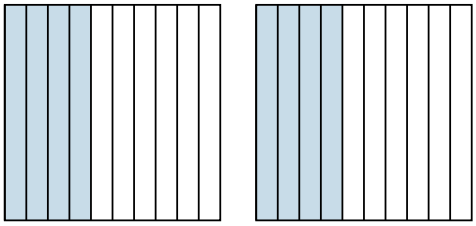

4) 2 × 0,81 =

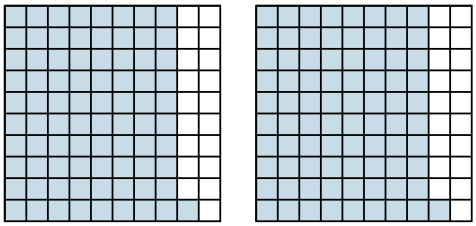

5) 2 × 0,25 =

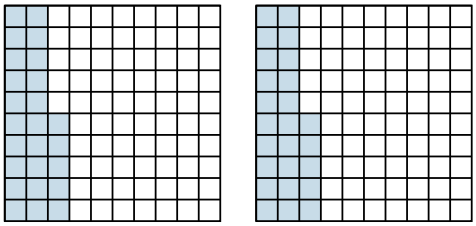

6) 4 × 0,8 =

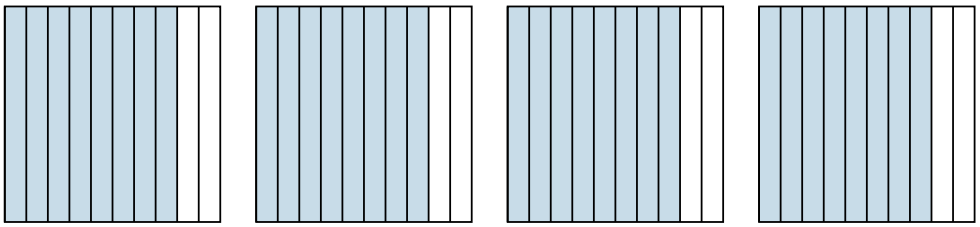

Réponses

1. $^{21}/_{10}$ = 2,1
2. $^{136}/_{100}$ = 1,36
3. $^{8}/_{10}$ = 0,8
4. $^{162}/_{100}$ = 1,62
5. $^{50}/_{100}$ = 0,5
6. $^{32}/_{10}$ = 3,2

1-6	83	67	50	33	17	0