Diviser avec une Droite Numérique

Nom:

Utilisez la droite numérique pour résoudre chaque problème.

1) 9÷3=

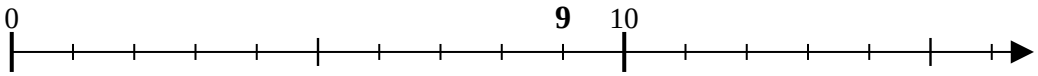

2) 6÷2=

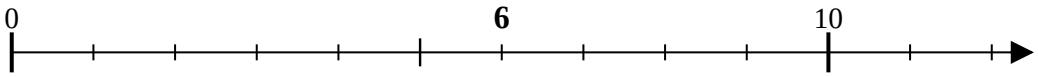

3) 12÷4=

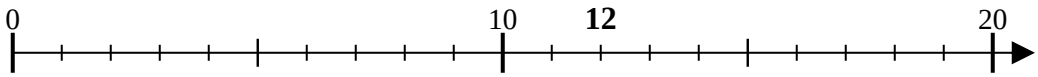

4) 15÷5=

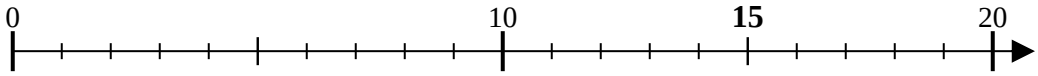

5) 28÷7=

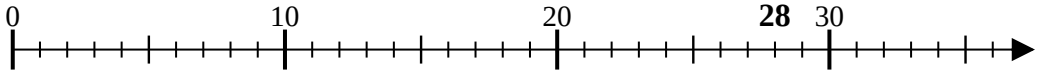

6) 40÷10=

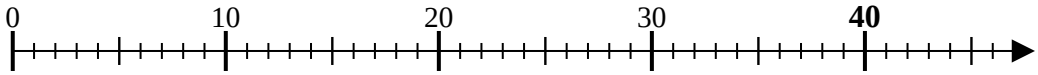

7) 24÷6=

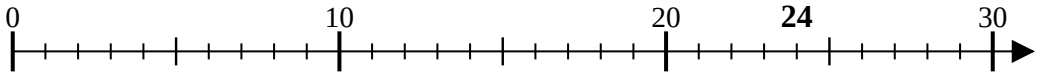

8) 30÷10=

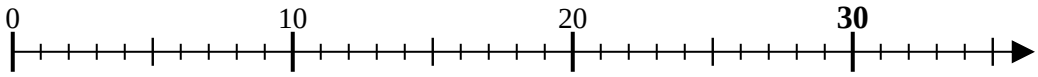

9) 30÷6=

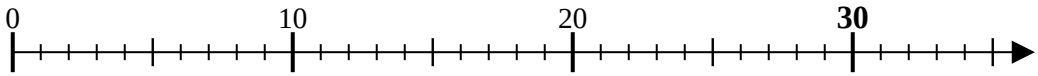

10) 12÷3=

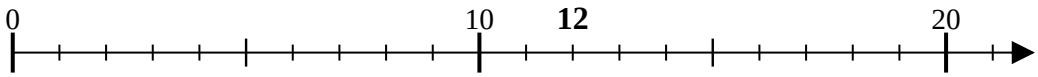

11) 18÷6=

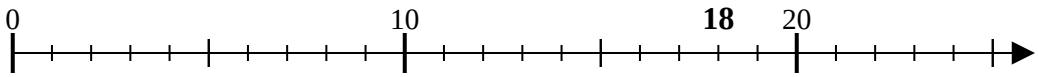

Réponses

1. _____
2. _____
3. _____
4. _____
5. _____
6. _____
7. _____
8. _____
9. _____
10. _____
11. _____

1-10	91	82	73	64	55	45	36	27	18	9
11	0									

Diviser avec une Droite Numérique Nom: **Clé**

Utilisez la droite numérique pour résoudre chaque problème.

1) 9÷3=

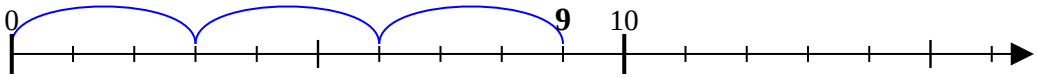

2) 6÷2=

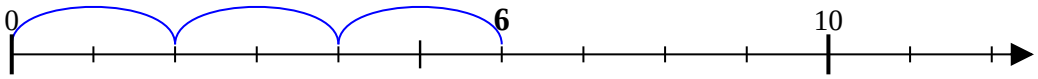

3) 12÷4=

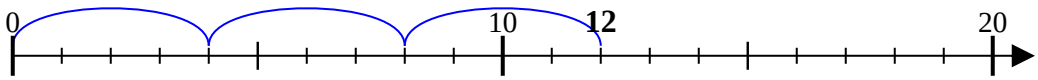

4) 15÷5=

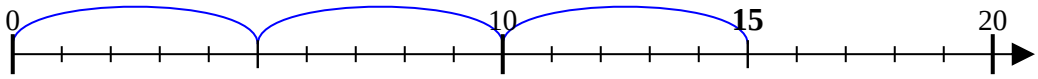

5) 28÷7=

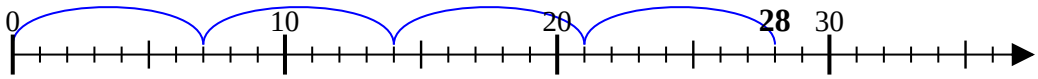

6) 40÷10=

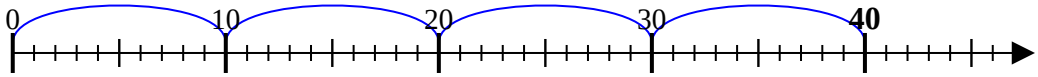

7) 24÷6=

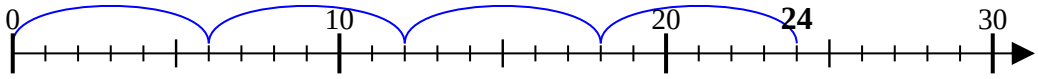

8) 30÷10=

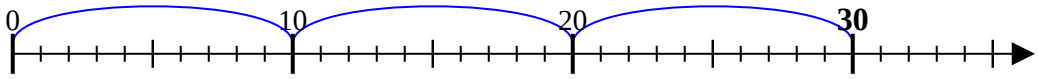

9) 30÷6=

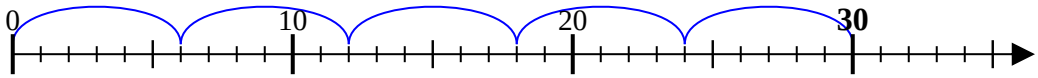

10) 12÷3=

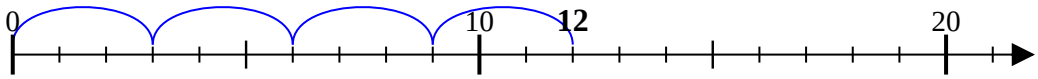

11) 18÷6=

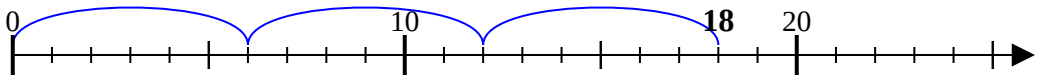

Réponses

1. 3
2. 3
3. 3
4. 3
5. 4
6. 4
7. 4
8. 3
9. 5
10. 4
11. 3

1-10	91	82	73	64	55	45	36	27	18	9
11	0									