Diviser avec une Droite Numérique Nom:

Utilisez la droite numérique pour résoudre chaque problème.

1) 30÷10=

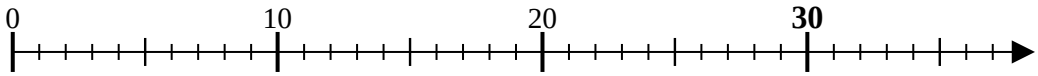

2) 28÷7=

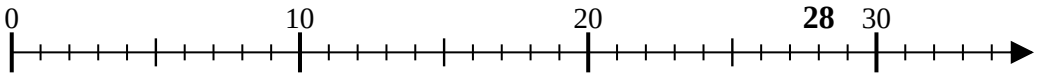

3) 6÷3=

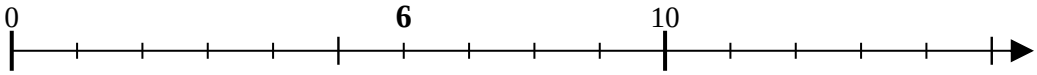

4) 32÷8=

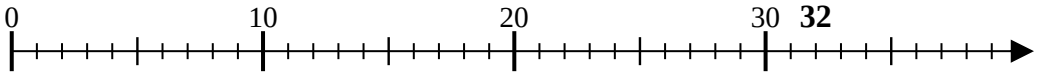

5) 15÷3=

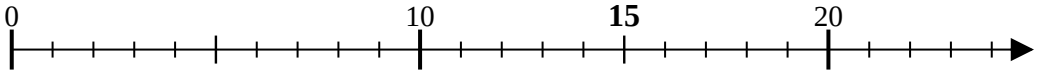

6) 10÷5=

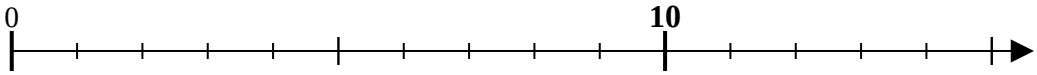

7) 18÷6=

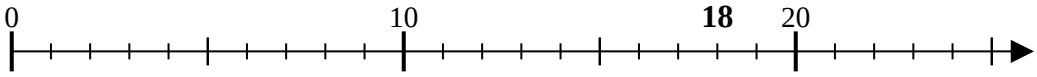

8) 20÷10=

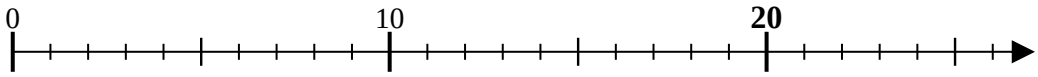

9) 36÷9=

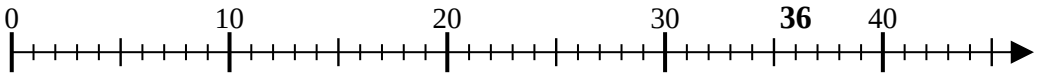

10) 20÷4=

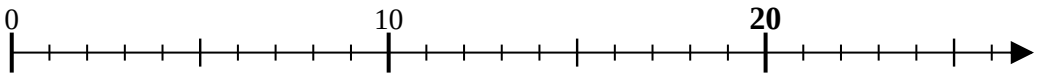

11) 9÷3=

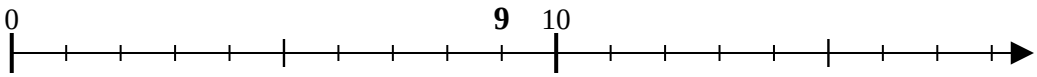

Réponses

1. _____
2. _____
3. _____
4. _____
5. _____
6. _____
7. _____
8. _____
9. _____
10. _____
11. _____

1-10	91	82	73	64	55	45	36	27	18	9
11	0									

Diviser avec une Droite Numérique Nom: **Clé**

Utilisez la droite numérique pour résoudre chaque problème.

1) 30÷10=

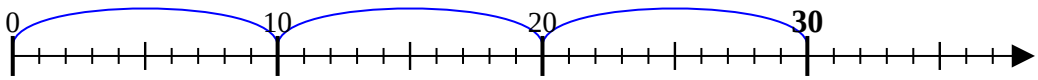

2) 28÷7=

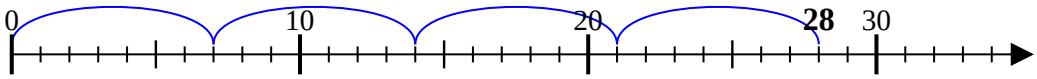

3) 6÷3=

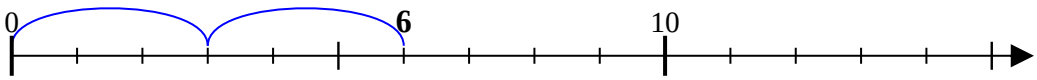

4) 32÷8=

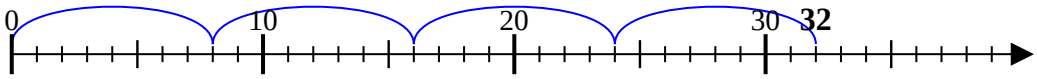

5) 15÷3=

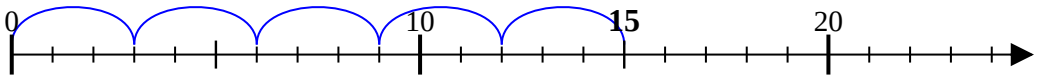

6) 10÷5=

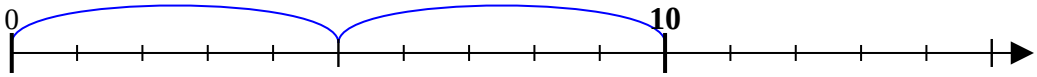

7) 18÷6=

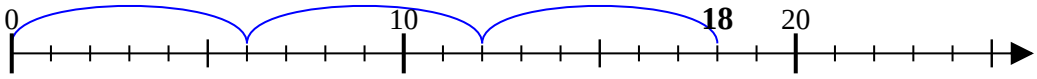

8) 20÷10=

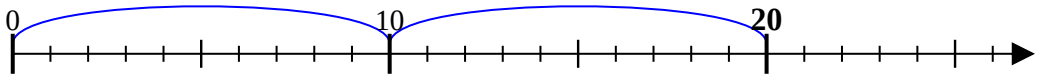

9) 36÷9=

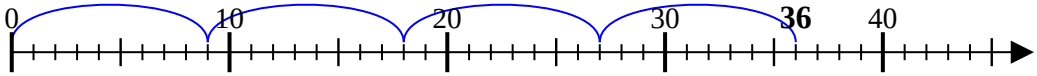

10) 20÷4=

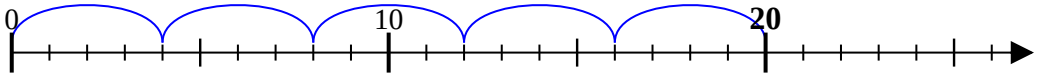

11) 9÷3=

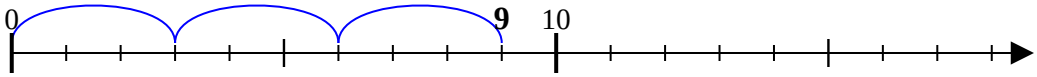

Réponses

1. 3
2. 4
3. 2
4. 4
5. 5
6. 2
7. 3
8. 2
9. 4
10. 5
11. 3

1-10	91	82	73	64	55	45	36	27	18	9
11	0									