Fraction, Décimal & Pourcentage (Visuel)

Nom:

Exprimez la valeur en fraction , décimal & pourcentage.

Ex)

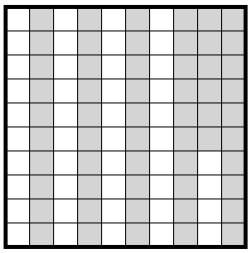

fraction $^{56}/_{100}$
décimal 0,56
pourcentage 56

1)

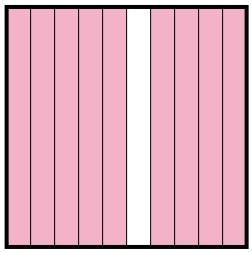

fraction _____
décimal _____
pourcentage _____

2)

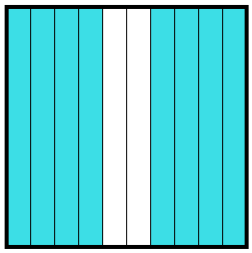

fraction _____
décimal _____
pourcentage _____

3)

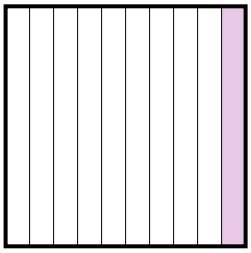

fraction _____
décimal _____
pourcentage _____

4)

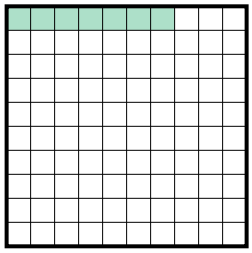

fraction _____
décimal _____
pourcentage _____

5)

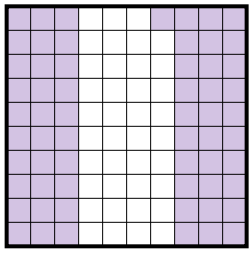

fraction _____
décimal _____
pourcentage _____

6)



fraction _____
décimal _____
pourcentage _____

7)

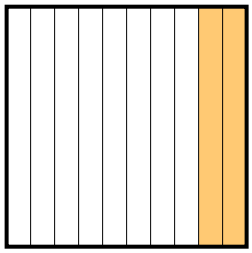

fraction _____
décimal _____
pourcentage _____

8)



fraction _____
décimal _____
pourcentage _____

9)

fraction _____
décimal _____
pourcentage _____

10)

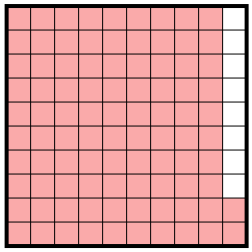

fraction _____
décimal _____
pourcentage _____

11)

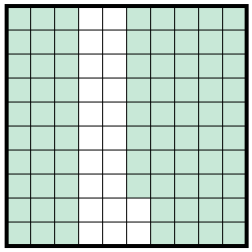

fraction _____
décimal _____
pourcentage _____

Réponses

Ex.	$^{56}/_{100}$	0,56	56%
1.			
2.			
3.			
4.			
5.			
6.			
7.			
8.			
9.			
10.			
11.			

1-10	91	82	73	64	55	45	36	27	18	9
11	0									

Fraction, Décimal & Pourcentage (Visuel) Nom: **Clé**

Exprimez la valeur en fraction , décimal & pourcentage.

Ex)

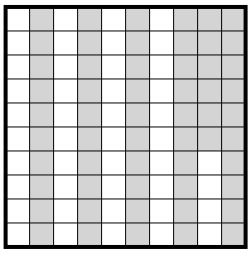

fraction $56/100$
décimal 0,56
pourcentage 56

1)

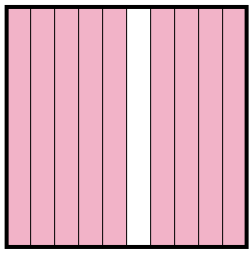

fraction $9/10$
décimal 0,9
pourcentage 90

2)

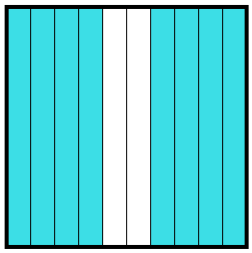

fraction $8/10$
décimal 0,8
pourcentage 80

3)

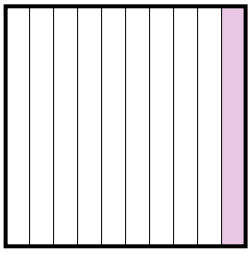

fraction $1/10$
décimal 0,1
pourcentage 10

4)

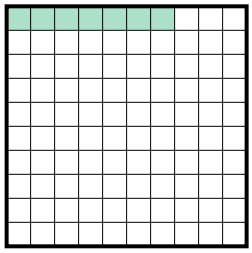

fraction $7/100$
décimal 0,07
pourcentage 7

5)

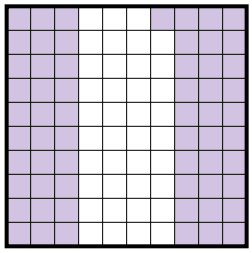

fraction $61/100$
décimal 0,61
pourcentage 61

6)



fraction $5/10$
décimal 0,5
pourcentage 50

7)

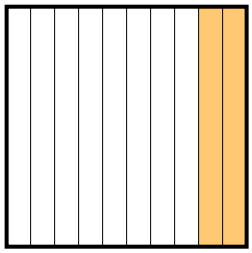

fraction $2/10$
décimal 0,2
pourcentage 20

8)



fraction $3/10$
décimal 0,3
pourcentage 30

9)

fraction $6/10$
décimal 0,6
pourcentage 60

10)

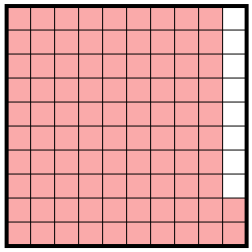

fraction $92/100$
décimal 0,92
pourcentage 92

11)

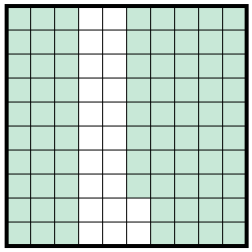

fraction $78/100$
décimal 0,78
pourcentage 78

Réponses

Ex.	$56/100$	0,56	56%
1.	$9/10$	0,9	90%
2.	$8/10$	0,8	80%
3.	$1/10$	0,1	10%
4.	$7/100$	0,07	7%
5.	$61/100$	0,61	61%
6.	$5/10$	0,5	50%
7.	$2/10$	0,2	20%
8.	$3/10$	0,3	30%
9.	$6/10$	0,6	60%
10.	$92/100$	0,92	92%
11.	$78/100$	0,78	78%

1-10	91	82	73	64	55	45	36	27	18	9
11	0									

Fraction, Décimal & Pourcentage (Visuel)

Nom:

Exprimez la valeur en fraction , décimal & pourcentage.

Ex)

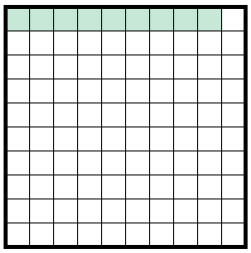

fraction $^{9}/_{100}$
décimal 0,09
pourcentage 9

1)

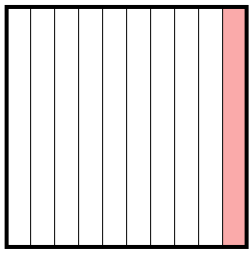

fraction _____
décimal _____
pourcentage _____

2)

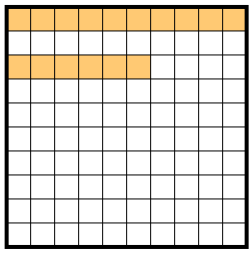

fraction _____
décimal _____
pourcentage _____

3)

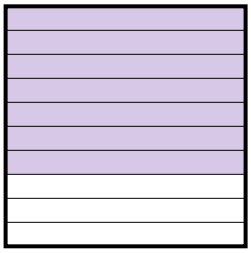

fraction _____
décimal _____
pourcentage _____

4)

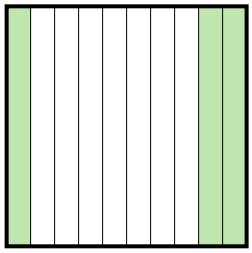

fraction _____
décimal _____
pourcentage _____

5)



fraction _____
décimal _____
pourcentage _____

6)

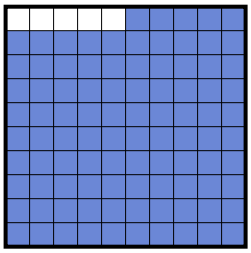

fraction _____
décimal _____
pourcentage _____

7)

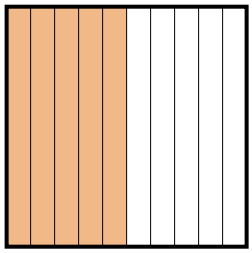

fraction _____
décimal _____
pourcentage _____

8)

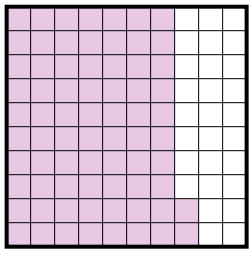

fraction _____
décimal _____
pourcentage _____

9)

fraction _____
décimal _____
pourcentage _____

10)



fraction _____
décimal _____
pourcentage _____

11)



fraction _____
décimal _____
pourcentage _____

Réponses

Ex.	$^{9}/_{100}$	0,09	9%
1.			
2.			
3.			
4.			
5.			
6.			
7.			
8.			
9.			
10.			
11.			

1-10	91	82	73	64	55	45	36	27	18	9
11	0									

Fraction, Décimal & Pourcentage (Visuel) Nom: **Clé**

Exprimez la valeur en fraction , décimal & pourcentage.

Ex)

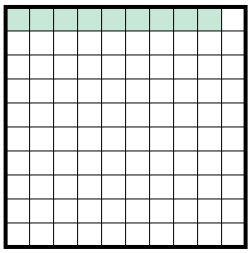

fraction $^{9}/_{100}$
décimal 0,09
pourcentage 9

1)

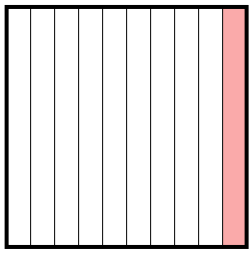

fraction $^{1}/_{10}$
décimal 0,1
pourcentage 10

2)

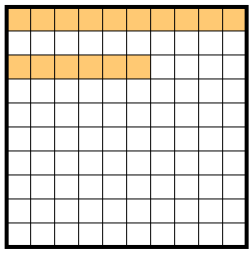

fraction $^{16}/_{100}$
décimal 0,16
pourcentage 16

3)

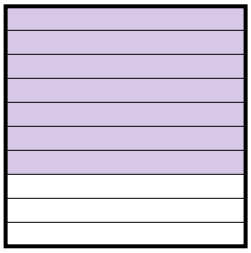

fraction $^{7}/_{10}$
décimal 0,7
pourcentage 70

4)

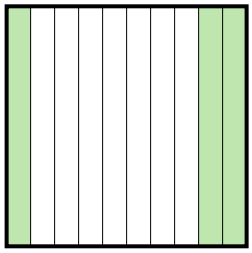

fraction $^{3}/_{10}$
décimal 0,3
pourcentage 30

5)



fraction $^{14}/_{100}$
décimal 0,14
pourcentage 14

6)

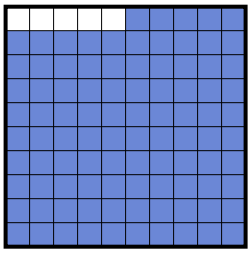

fraction $^{95}/_{100}$
décimal 0,95
pourcentage 95

7)

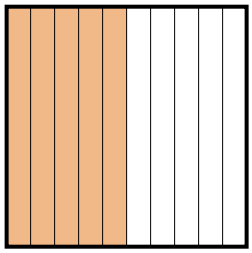

fraction $^{5}/_{10}$
décimal 0,5
pourcentage 50

8)

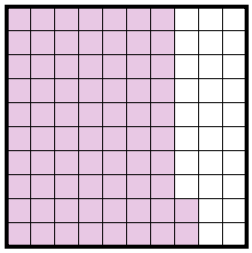

fraction $^{72}/_{100}$
décimal 0,72
pourcentage 72

9)

fraction $^{4}/_{10}$
décimal 0,4
pourcentage 40

10)



fraction $^{2}/_{10}$
décimal 0,2
pourcentage 20

11)



fraction $^{6}/_{10}$
décimal 0,6
pourcentage 60

Réponses

Ex.	$^{9}/_{100}$	0,09	9%
1.	$^{1}/_{10}$	0,1	10%
2.	$^{16}/_{100}$	0,16	16%
3.	$^{7}/_{10}$	0,7	70%
4.	$^{3}/_{10}$	0,3	30%
5.	$^{14}/_{100}$	0,14	14%
6.	$^{95}/_{100}$	0,95	95%
7.	$^{5}/_{10}$	0,5	50%
8.	$^{72}/_{100}$	0,72	72%
9.	$^{4}/_{10}$	0,4	40%
10.	$^{2}/_{10}$	0,2	20%
11.	$^{6}/_{10}$	0,6	60%

1-10	91	82	73	64	55	45	36	27	18	9
11	0									

Fraction, Décimal & Pourcentage (Visuel)

Nom:

Exprimez la valeur en fraction , décimal & pourcentage.

Ex)

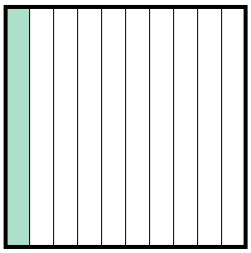

fraction $\frac{1}{10}$
décimal 0,1
pourcentage 10

1)

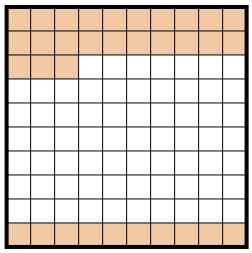

fraction _____
décimal _____
pourcentage _____

2)

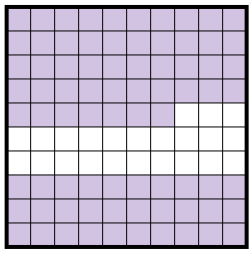

fraction _____
décimal _____
pourcentage _____

3)

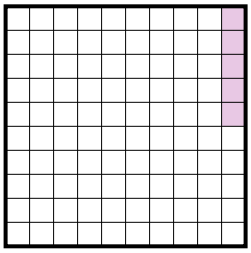

fraction _____
décimal _____
pourcentage _____

4)

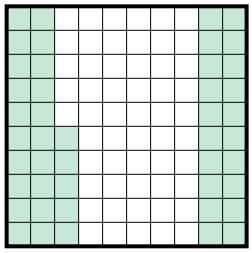

fraction _____
décimal _____
pourcentage _____

5)

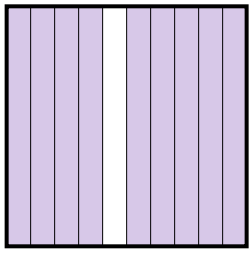

fraction _____
décimal _____
pourcentage _____

6)

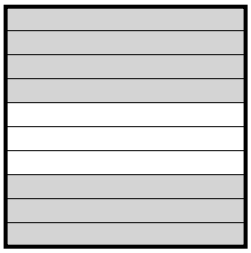

fraction _____
décimal _____
pourcentage _____

7)



fraction _____
décimal _____
pourcentage _____

8)



fraction _____
décimal _____
pourcentage _____

9)

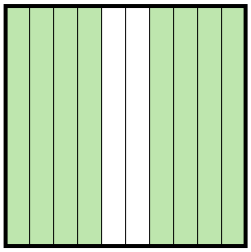

fraction _____
décimal _____
pourcentage _____

10)

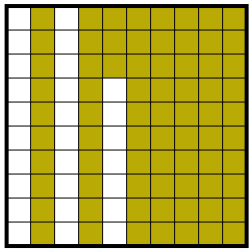

fraction _____
décimal _____
pourcentage _____

11)

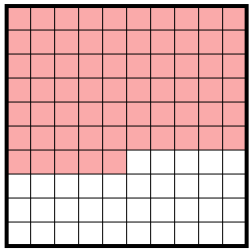

fraction _____
décimal _____
pourcentage _____

Réponses

Ex.	$\frac{1}{10}$	0,1	10%
1.			
2.			
3.			
4.			
5.			
6.			
7.			
8.			
9.			
10.			
11.			

1-10	91	82	73	64	55	45	36	27	18	9
11	0									

Fraction, Décimal & Pourcentage (Visuel) Nom: **Clé**

Exprimez la valeur en fraction , décimal & pourcentage.

Ex)

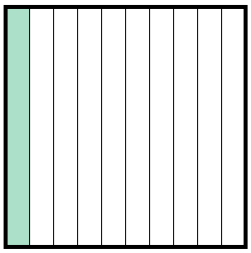

fraction $\frac{1}{10}$
décimal 0,1
pourcentage 10

1)

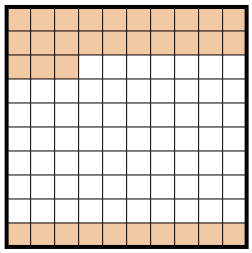

fraction $\frac{33}{100}$
décimal 0,33
pourcentage 33

2)

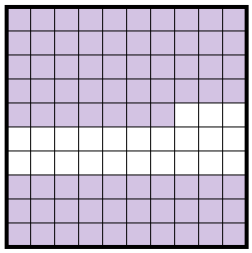

fraction $\frac{77}{100}$
décimal 0,77
pourcentage 77

3)

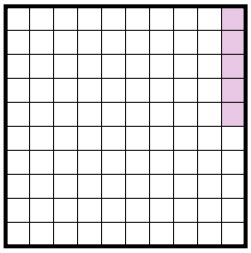

fraction $\frac{5}{100}$
décimal 0,05
pourcentage 5

4)

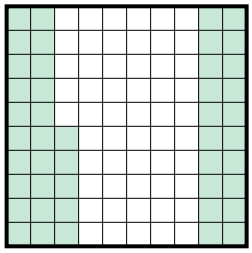

fraction $\frac{45}{100}$
décimal 0,45
pourcentage 45

5)

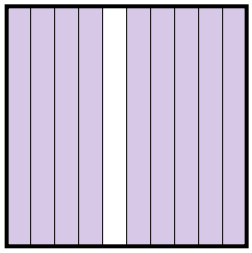

fraction $\frac{9}{10}$
décimal 0,9
pourcentage 90

6)

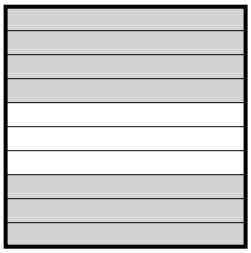

fraction $\frac{7}{10}$
décimal 0,7
pourcentage 70

7)



fraction $\frac{3}{10}$
décimal 0,3
pourcentage 30

8)



fraction $\frac{2}{10}$
décimal 0,2
pourcentage 20

9)

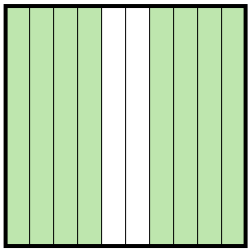

fraction $\frac{8}{10}$
décimal 0,8
pourcentage 80

10)

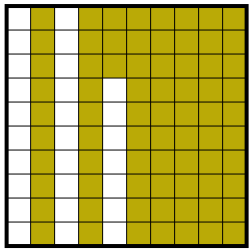

fraction $\frac{73}{100}$
décimal 0,73
pourcentage 73

11)

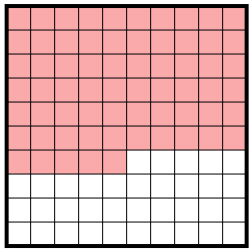

fraction $\frac{65}{100}$
décimal 0,65
pourcentage 65

Réponses

Ex.	$\frac{1}{10}$	0,1	10%
1.	$\frac{33}{100}$	0,33	33%
2.	$\frac{77}{100}$	0,77	77%
3.	$\frac{5}{100}$	0,05	5%
4.	$\frac{45}{100}$	0,45	45%
5.	$\frac{9}{10}$	0,9	90%
6.	$\frac{7}{10}$	0,7	70%
7.	$\frac{3}{10}$	0,3	30%
8.	$\frac{2}{10}$	0,2	20%
9.	$\frac{8}{10}$	0,8	80%
10.	$\frac{73}{100}$	0,73	73%
11.	$\frac{65}{100}$	0,65	65%

1-10	91	82	73	64	55	45	36	27	18	9
11	0									

Fraction, Décimal & Pourcentage (Visuel)

Nom:

Exprimez la valeur en fraction , décimal & pourcentage.

Ex)

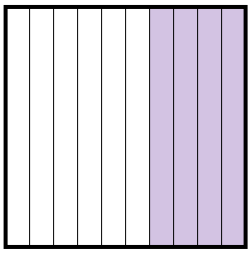

fraction $^{4}/_{10}$
décimal 0,4
pourcentage 40

1)

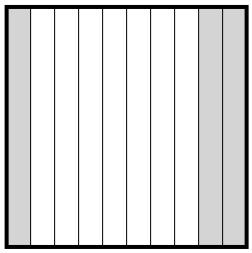

fraction _____
décimal _____
pourcentage _____

2)

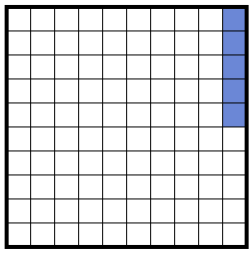

fraction _____
décimal _____
pourcentage _____

3)

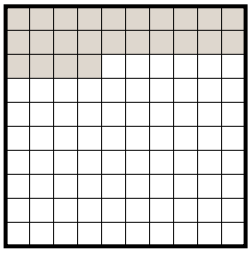

fraction _____
décimal _____
pourcentage _____

4)

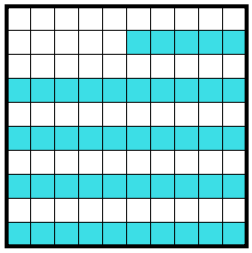

fraction _____
décimal _____
pourcentage _____

5)

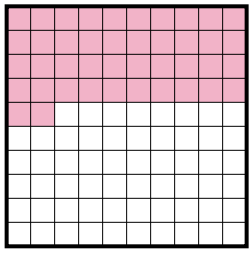

fraction _____
décimal _____
pourcentage _____

6)



fraction _____
décimal _____
pourcentage _____

7)



fraction _____
décimal _____
pourcentage _____

8)

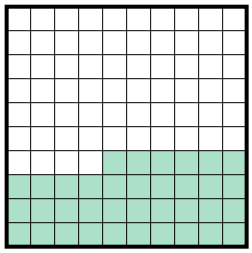

fraction _____
décimal _____
pourcentage _____

9)

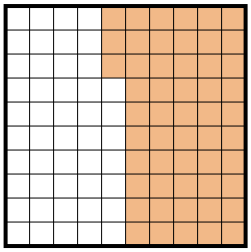

fraction _____
décimal _____
pourcentage _____

10)

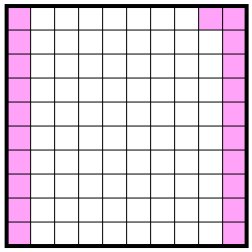

fraction _____
décimal _____
pourcentage _____

11)



fraction _____
décimal _____
pourcentage _____

Réponses

Ex.	$^{4}/_{10}$	0,4	40%
1.			
2.			
3.			
4.			
5.			
6.			
7.			
8.			
9.			
10.			
11.			

1-10	91	82	73	64	55	45	36	27	18	9
11	0									

Fraction, Décimal & Pourcentage (Visuel) Nom: **Clé**

Exprimez la valeur en fraction , décimal & pourcentage.

Ex)

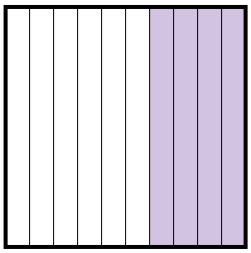

fraction $\frac{4}{10}$
décimal 0,4
pourcentage 40

1)

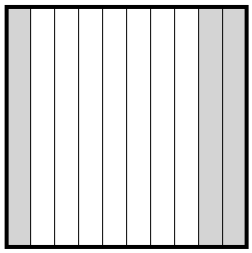

fraction $\frac{3}{10}$
décimal 0,3
pourcentage 30

2)

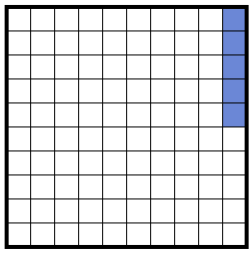

fraction $\frac{5}{100}$
décimal 0,05
pourcentage 5

3)

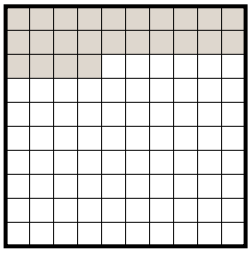

fraction $\frac{24}{100}$
décimal 0,24
pourcentage 24

4)

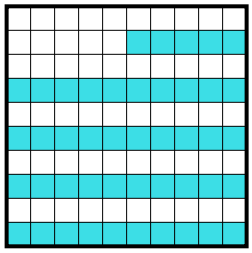

fraction $\frac{45}{100}$
décimal 0,45
pourcentage 45

5)

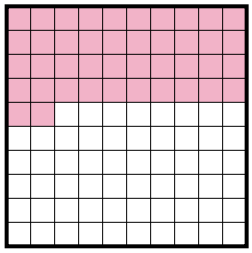

fraction $\frac{42}{100}$
décimal 0,42
pourcentage 42

6)



fraction $\frac{2}{10}$
décimal 0,2
pourcentage 20

7)



fraction $\frac{1}{10}$
décimal 0,1
pourcentage 10

8)

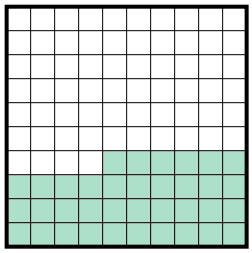

fraction $\frac{36}{100}$
décimal 0,36
pourcentage 36

9)

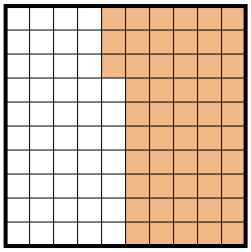

fraction $\frac{53}{100}$
décimal 0,53
pourcentage 53

10)

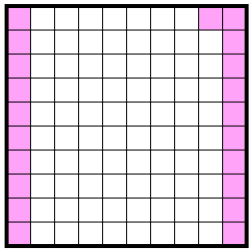

fraction $\frac{21}{100}$
décimal 0,21
pourcentage 21

11)



fraction $\frac{8}{10}$
décimal 0,8
pourcentage 80

Réponses

Ex.	$\frac{4}{10}$	0,4	40%
1.	$\frac{3}{10}$	0,3	30%
2.	$\frac{5}{100}$	0,05	5%
3.	$\frac{24}{100}$	0,24	24%
4.	$\frac{45}{100}$	0,45	45%
5.	$\frac{42}{100}$	0,42	42%
6.	$\frac{2}{10}$	0,2	20%
7.	$\frac{1}{10}$	0,1	10%
8.	$\frac{36}{100}$	0,36	36%
9.	$\frac{53}{100}$	0,53	53%
10.	$\frac{21}{100}$	0,21	21%
11.	$\frac{8}{10}$	0,8	80%

1-10	91	82	73	64	55	45	36	27	18	9
11	0									

Fraction, Décimal & Pourcentage (Visuel)

Nom:

Exprimez la valeur en fraction , décimal & pourcentage.

Ex)

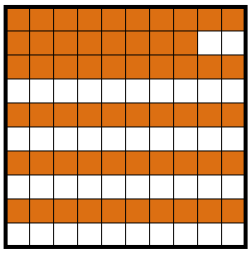

fraction $^{58}/_{100}$
décimal 0,58
pourcentage 58

1)

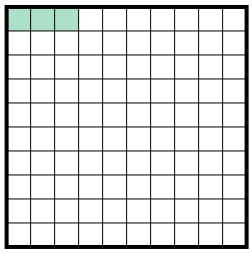

fraction _____
décimal _____
pourcentage _____

2)

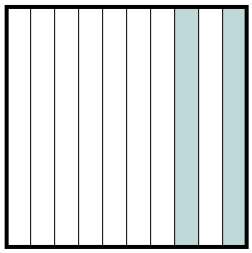

fraction _____
décimal _____
pourcentage _____

3)



fraction _____
décimal _____
pourcentage _____

4)

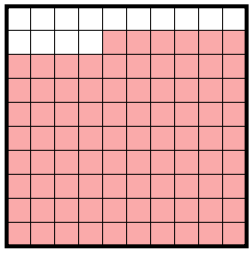

fraction _____
décimal _____
pourcentage _____

5)

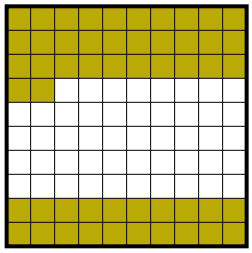

fraction _____
décimal _____
pourcentage _____

6)

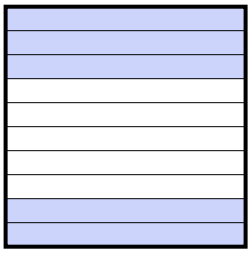

fraction _____
décimal _____
pourcentage _____

7)

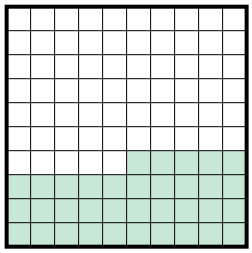

fraction _____
décimal _____
pourcentage _____

8)

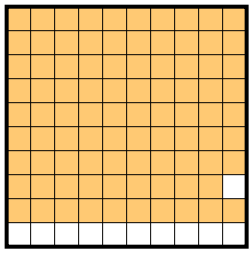

fraction _____
décimal _____
pourcentage _____

9)

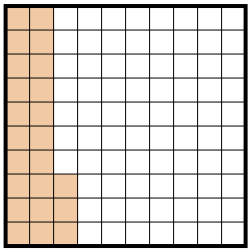

fraction _____
décimal _____
pourcentage _____

10)

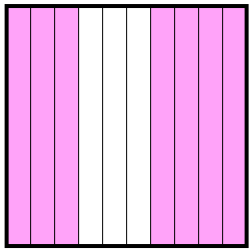

fraction _____
décimal _____
pourcentage _____

11)

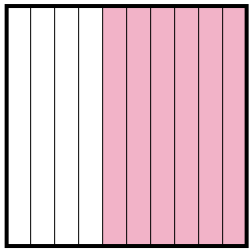

fraction _____
décimal _____
pourcentage _____

Réponses

Ex.	$^{58}/_{100}$	0,58	58%
1.			
2.			
3.			
4.			
5.			
6.			
7.			
8.			
9.			
10.			
11.			

1-10	91	82	73	64	55	45	36	27	18	9
11	0									

Fraction, Décimal & Pourcentage (Visuel) Nom: **Clé**

Exprimez la valeur en fraction , décimal & pourcentage.

Ex)

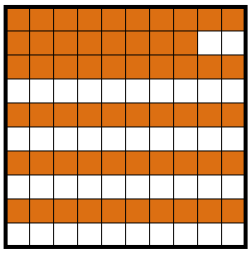

fraction $^{58}/_{100}$
décimal 0,58
pourcentage 58

1)

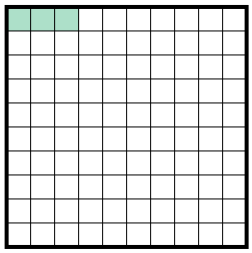

fraction $^{3}/_{100}$
décimal 0,03
pourcentage 3

2)

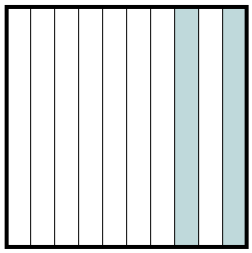

fraction $^{2}/_{10}$
décimal 0,2
pourcentage 20

3)



fraction $^{4}/_{10}$
décimal 0,4
pourcentage 40

4)

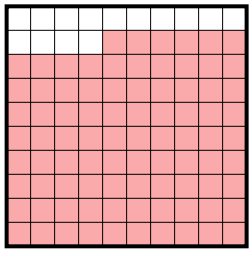

fraction $^{86}/_{100}$
décimal 0,86
pourcentage 86

5)

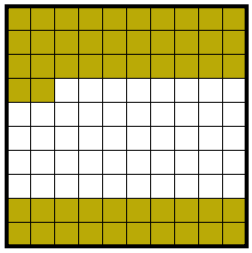

fraction $^{52}/_{100}$
décimal 0,52
pourcentage 52

6)

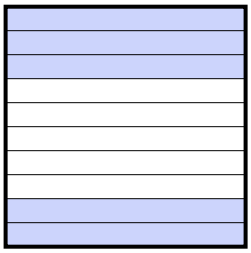

fraction $^{5}/_{10}$
décimal 0,5
pourcentage 50

7)

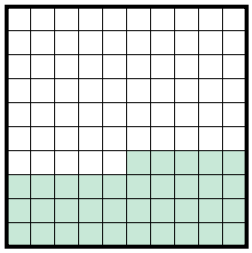

fraction $^{35}/_{100}$
décimal 0,35
pourcentage 35

8)

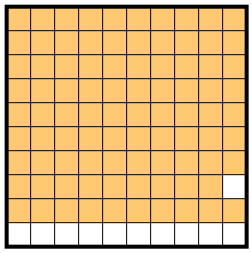

fraction $^{89}/_{100}$
décimal 0,89
pourcentage 89

9)

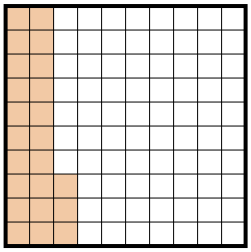

fraction $^{23}/_{100}$
décimal 0,23
pourcentage 23

10)

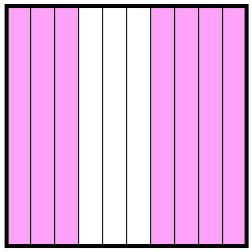

fraction $^{7}/_{10}$
décimal 0,7
pourcentage 70

11)

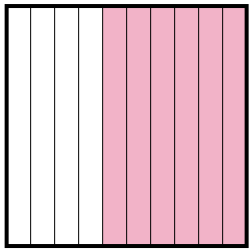

fraction $^{6}/_{10}$
décimal 0,6
pourcentage 60

Réponses

Ex.	$^{58}/_{100}$	0,58	58%
1.	$^{3}/_{100}$	0,03	3%
2.	$^{2}/_{10}$	0,2	20%
3.	$^{4}/_{10}$	0,4	40%
4.	$^{86}/_{100}$	0,86	86%
5.	$^{52}/_{100}$	0,52	52%
6.	$^{5}/_{10}$	0,5	50%
7.	$^{35}/_{100}$	0,35	35%
8.	$^{89}/_{100}$	0,89	89%
9.	$^{23}/_{100}$	0,23	23%
10.	$^{7}/_{10}$	0,7	70%
11.	$^{6}/_{10}$	0,6	60%

1-10	91	82	73	64	55	45	36	27	18	9
11	0									

Fraction, Décimal & Pourcentage (Visuel)

Nom:

Exprimez la valeur en fraction , décimal & pourcentage.

Ex)

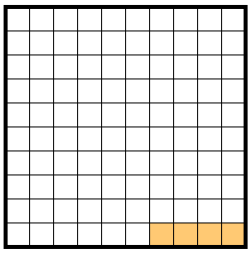

fraction $^{4}/_{100}$
décimal 0,04
pourcentage 4

1)

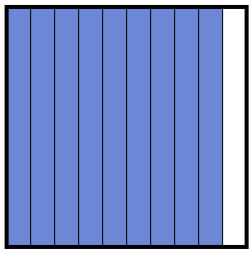

fraction _____
décimal _____
pourcentage _____

2)



fraction _____
décimal _____
pourcentage _____

3)



fraction _____
décimal _____
pourcentage _____

4)

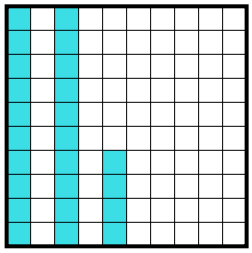

fraction _____
décimal _____
pourcentage _____

5)

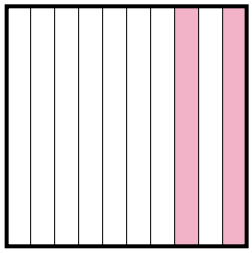

fraction _____
décimal _____
pourcentage _____

6)

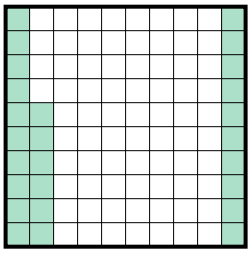

fraction _____
décimal _____
pourcentage _____

7)

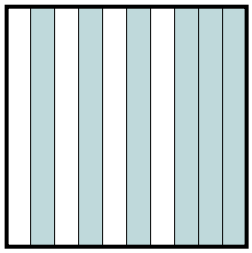

fraction _____
décimal _____
pourcentage _____

8)

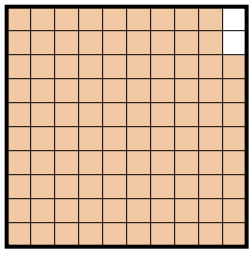

fraction _____
décimal _____
pourcentage _____

9)

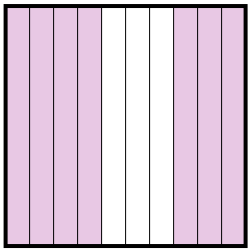

fraction _____
décimal _____
pourcentage _____

10)

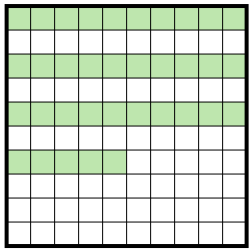

fraction _____
décimal _____
pourcentage _____

11)

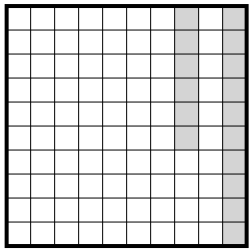

fraction _____
décimal _____
pourcentage _____

Réponses

Ex.	$^{4}/_{100}$	0,04	4%
1.			
2.			
3.			
4.			
5.			
6.			
7.			
8.			
9.			
10.			
11.			

1-10	91	82	73	64	55	45	36	27	18	9
11	0									

Fraction, Décimal & Pourcentage (Visuel) Nom: **Clé**

Exprimez la valeur en fraction , décimal & pourcentage.

Ex)

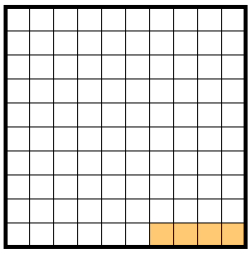

fraction $\frac{4}{100}$
décimal 0,04
pourcentage 4

1)

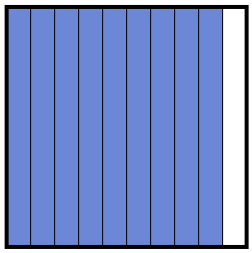

fraction $\frac{9}{10}$
décimal 0,9
pourcentage 90

2)



fraction $\frac{8}{10}$
décimal 0,8
pourcentage 80

3)



fraction $\frac{3}{10}$
décimal 0,3
pourcentage 30

4)

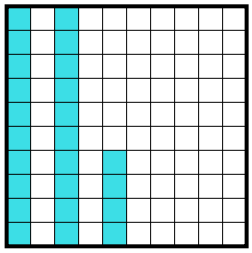

fraction $\frac{24}{100}$
décimal 0,24
pourcentage 24

5)

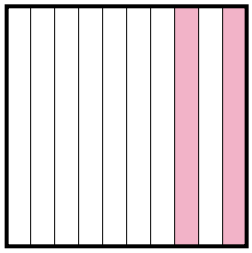

fraction $\frac{2}{10}$
décimal 0,2
pourcentage 20

6)

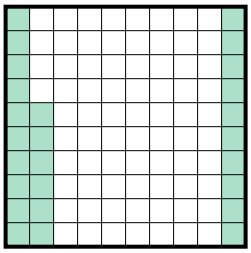

fraction $\frac{26}{100}$
décimal 0,26
pourcentage 26

7)

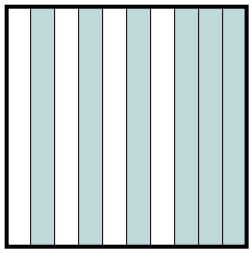

fraction $\frac{6}{10}$
décimal 0,6
pourcentage 60

8)

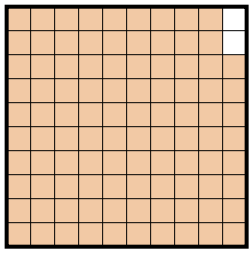

fraction $\frac{98}{100}$
décimal 0,98
pourcentage 98

9)

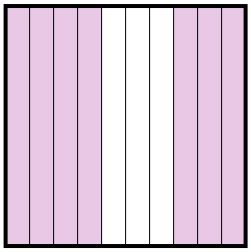

fraction $\frac{7}{10}$
décimal 0,7
pourcentage 70

10)

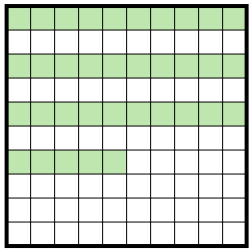

fraction $\frac{35}{100}$
décimal 0,35
pourcentage 35

11)

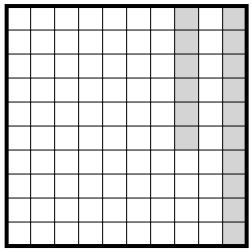

fraction $\frac{16}{100}$
décimal 0,16
pourcentage 16

Réponses

Ex.	$\frac{4}{100}$	0,04	4%
1.	$\frac{9}{10}$	0,9	90%
2.	$\frac{8}{10}$	0,8	80%
3.	$\frac{3}{10}$	0,3	30%
4.	$\frac{24}{100}$	0,24	24%
5.	$\frac{2}{10}$	0,2	20%
6.	$\frac{26}{100}$	0,26	26%
7.	$\frac{6}{10}$	0,6	60%
8.	$\frac{98}{100}$	0,98	98%
9.	$\frac{7}{10}$	0,7	70%
10.	$\frac{35}{100}$	0,35	35%
11.	$\frac{16}{100}$	0,16	16%

1-10	91	82	73	64	55	45	36	27	18	9
11	0									

Fraction, Décimal & Pourcentage (Visuel) Nom:

Exprimez la valeur en fraction , décimal & pourcentage.

Ex)



fraction $^{9}/_{10}$
décimal 0,9
pourcentage 90

1)



fraction _____
décimal _____
pourcentage _____

2)

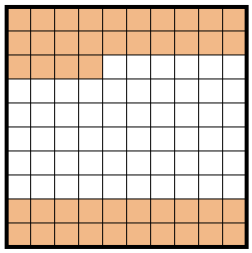

fraction _____
décimal _____
pourcentage _____

3)

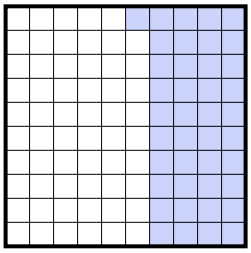

fraction _____
décimal _____
pourcentage _____

4)



fraction _____
décimal _____
pourcentage _____

5)

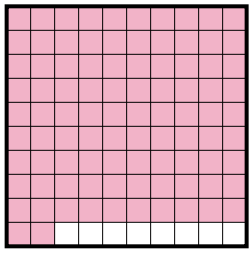

fraction _____
décimal _____
pourcentage _____

6)

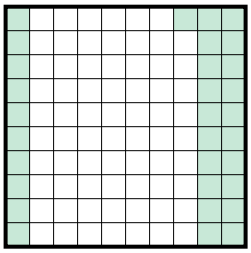

fraction _____
décimal _____
pourcentage _____

7)

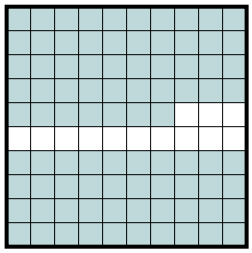

fraction _____
décimal _____
pourcentage _____

8)

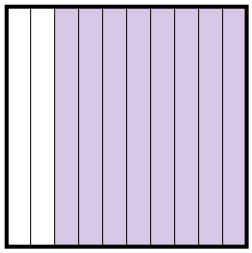

fraction _____
décimal _____
pourcentage _____

9)

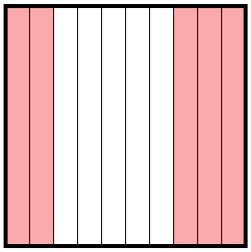

fraction _____
décimal _____
pourcentage _____

10)

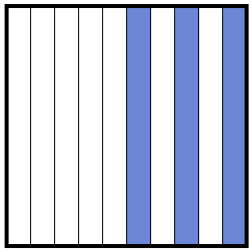

fraction _____
décimal _____
pourcentage _____

11)

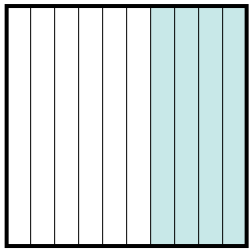

fraction _____
décimal _____
pourcentage _____

Réponses

Ex.	$^{9}/_{10}$	0,9	90%
1.			
2.			
3.			
4.			
5.			
6.			
7.			
8.			
9.			
10.			
11.			

1-10	91	82	73	64	55	45	36	27	18	9
11	0									

Fraction, Décimal & Pourcentage (Visuel) Nom: **Clé**

Exprimez la valeur en fraction , décimal & pourcentage.

Ex)



fraction $^{9}/_{10}$
décimal 0,9
pourcentage 90

1)



fraction $^{2}/_{10}$
décimal 0,2
pourcentage 20

2)

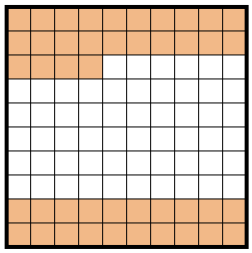

fraction $^{44}/_{100}$
décimal 0,44
pourcentage 44

3)

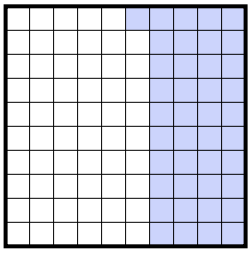

fraction $^{41}/_{100}$
décimal 0,41
pourcentage 41

4)



fraction $^{6}/_{10}$
décimal 0,6
pourcentage 60

5)

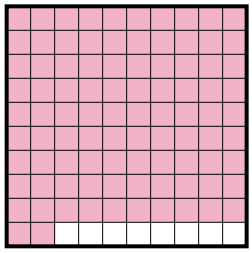

fraction $^{92}/_{100}$
décimal 0,92
pourcentage 92

6)

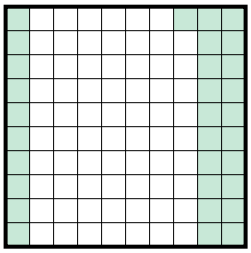

fraction $^{31}/_{100}$
décimal 0,31
pourcentage 31

7)

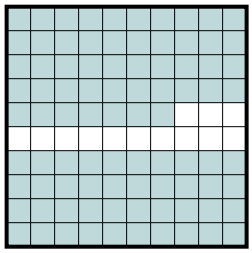

fraction $^{87}/_{100}$
décimal 0,87
pourcentage 87

8)

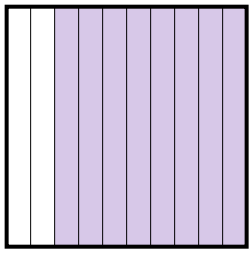

fraction $^{8}/_{10}$
décimal 0,8
pourcentage 80

9)

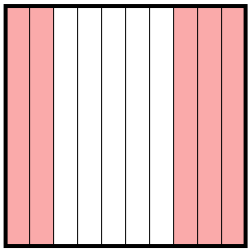

fraction $^{5}/_{10}$
décimal 0,5
pourcentage 50

10)

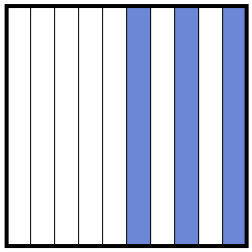

fraction $^{3}/_{10}$
décimal 0,3
pourcentage 30

11)

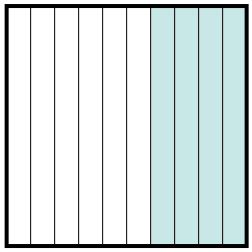

fraction $^{4}/_{10}$
décimal 0,4
pourcentage 40

Réponses

Ex.	$^{9}/_{10}$	0,9	90%
1.	$^{2}/_{10}$	0,2	20%
2.	$^{44}/_{100}$	0,44	44%
3.	$^{41}/_{100}$	0,41	41%
4.	$^{6}/_{10}$	0,6	60%
5.	$^{92}/_{100}$	0,92	92%
6.	$^{31}/_{100}$	0,31	31%
7.	$^{87}/_{100}$	0,87	87%
8.	$^{8}/_{10}$	0,8	80%
9.	$^{5}/_{10}$	0,5	50%
10.	$^{3}/_{10}$	0,3	30%
11.	$^{4}/_{10}$	0,4	40%

1-10	91	82	73	64	55	45	36	27	18	9
11	0									

Fraction, Décimal & Pourcentage (Visuel) Nom:

Exprimez la valeur en fraction , décimal & pourcentage.

Ex)



fraction $^{86}/_{100}$
décimal 0,86
pourcentage 86

1)

fraction _____
décimal _____
pourcentage _____

2)

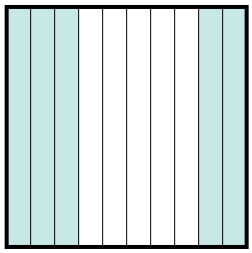

fraction _____
décimal _____
pourcentage _____

3)

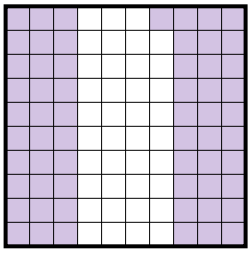

fraction _____
décimal _____
pourcentage _____

4)

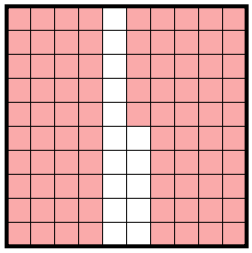

fraction _____
décimal _____
pourcentage _____

5)

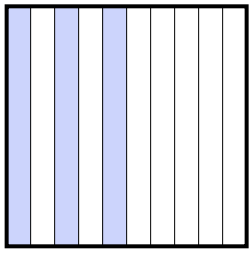

fraction _____
décimal _____
pourcentage _____

6)

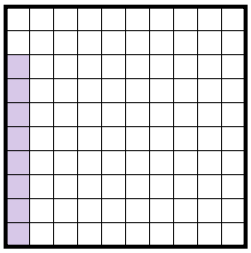

fraction _____
décimal _____
pourcentage _____

7)

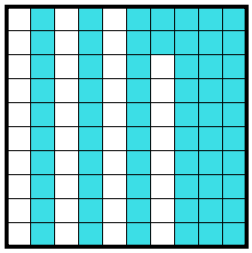

fraction _____
décimal _____
pourcentage _____

8)

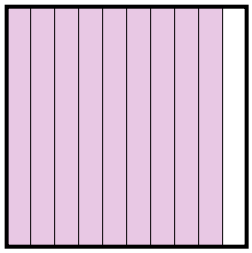

fraction _____
décimal _____
pourcentage _____

9)

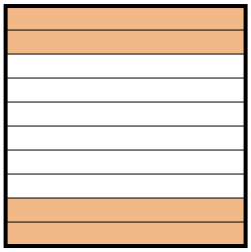

fraction _____
décimal _____
pourcentage _____

10)

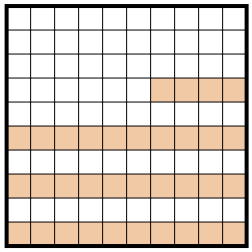

fraction _____
décimal _____
pourcentage _____

11)



fraction _____
décimal _____
pourcentage _____

Réponses

Ex.	$^{86}/_{100}$	0,86	86%
1.			
2.			
3.			
4.			
5.			
6.			
7.			
8.			
9.			
10.			
11.			

1-10	91	82	73	64	55	45	36	27	18	9
11	0									

Fraction, Décimal & Pourcentage (Visuel) Nom: **Clé**

Exprimez la valeur en fraction , décimal & pourcentage.

Ex)



fraction $^{86}/_{100}$
décimal 0,86
pourcentage 86

1)

fraction $^{2}/_{10}$
décimal 0,2
pourcentage 20

2)

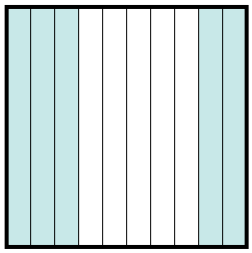

fraction $^{5}/_{10}$
décimal 0,5
pourcentage 50

3)

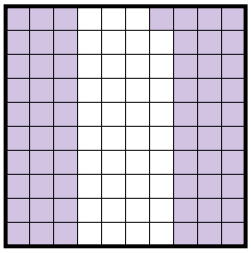

fraction $^{61}/_{100}$
décimal 0,61
pourcentage 61

4)

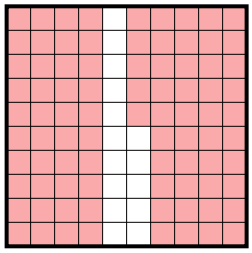

fraction $^{85}/_{100}$
décimal 0,85
pourcentage 85

5)

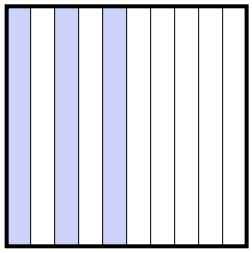

fraction $^{3}/_{10}$
décimal 0,3
pourcentage 30

6)

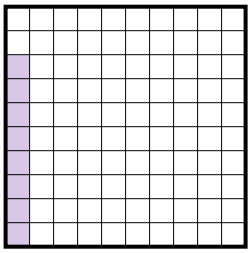

fraction $^{8}/_{100}$
décimal 0,08
pourcentage 8

7)

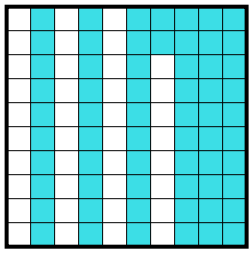

fraction $^{62}/_{100}$
décimal 0,62
pourcentage 62

8)

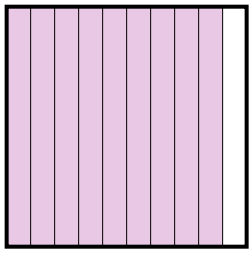

fraction $^{9}/_{10}$
décimal 0,9
pourcentage 90

9)

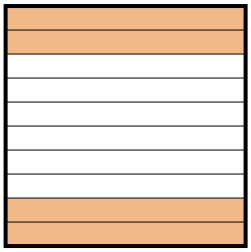

fraction $^{4}/_{10}$
décimal 0,4
pourcentage 40

10)

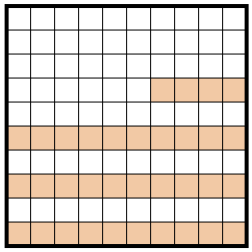

fraction $^{34}/_{100}$
décimal 0,34
pourcentage 34

11)



fraction $^{7}/_{10}$
décimal 0,7
pourcentage 70

Réponses

Ex.	$^{86}/_{100}$	0,86	86%
1.	$^{2}/_{10}$	0,2	20%
2.	$^{5}/_{10}$	0,5	50%
3.	$^{61}/_{100}$	0,61	61%
4.	$^{85}/_{100}$	0,85	85%
5.	$^{3}/_{10}$	0,3	30%
6.	$^{8}/_{100}$	0,08	8%
7.	$^{62}/_{100}$	0,62	62%
8.	$^{9}/_{10}$	0,9	90%
9.	$^{4}/_{10}$	0,4	40%
10.	$^{34}/_{100}$	0,34	34%
11.	$^{7}/_{10}$	0,7	70%

1-10	91	82	73	64	55	45	36	27	18	9
11	0									

Fraction, Décimal & Pourcentage (Visuel) Nom:

Exprimez la valeur en fraction , décimal & pourcentage.

Ex)

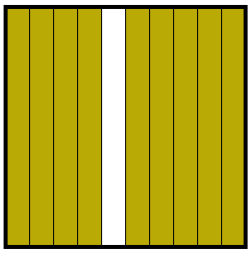

fraction $^{9}/_{10}$
décimal 0,9
pourcentage 90

1)

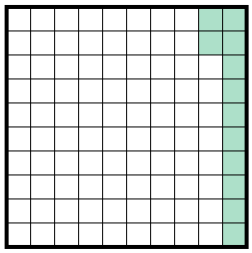

fraction _____
décimal _____
pourcentage _____

2)

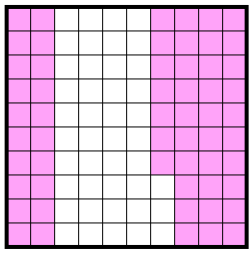

fraction _____
décimal _____
pourcentage _____

3)

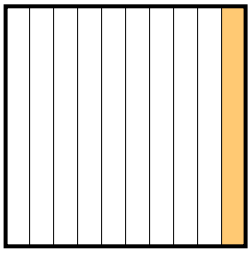

fraction _____
décimal _____
pourcentage _____

4)

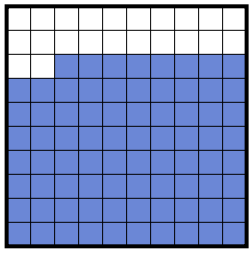

fraction _____
décimal _____
pourcentage _____

5)

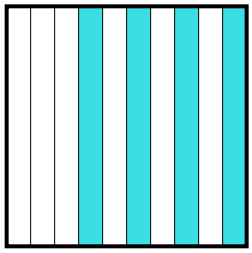

fraction _____
décimal _____
pourcentage _____

6)

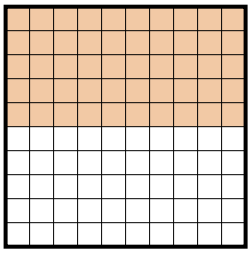

fraction _____
décimal _____
pourcentage _____

7)

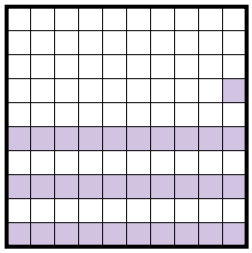

fraction _____
décimal _____
pourcentage _____

8)

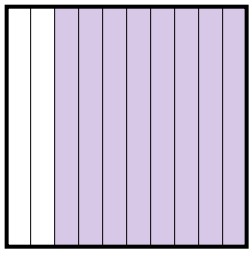

fraction _____
décimal _____
pourcentage _____

9)

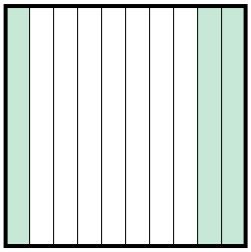

fraction _____
décimal _____
pourcentage _____

10)

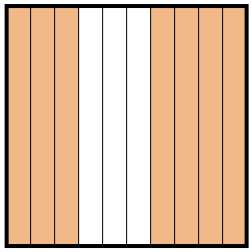

fraction _____
décimal _____
pourcentage _____

11)

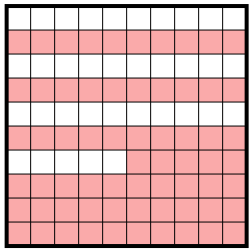

fraction _____
décimal _____
pourcentage _____

Réponses

Ex.	$^{9}/_{10}$	0,9	90%
1.			
2.			
3.			
4.			
5.			
6.			
7.			
8.			
9.			
10.			
11.			

1-10	91	82	73	64	55	45	36	27	18	9
11	0									

Fraction, Décimal & Pourcentage (Visuel) Nom: **Clé**

Exprimez la valeur en fraction , décimal & pourcentage.

Ex)

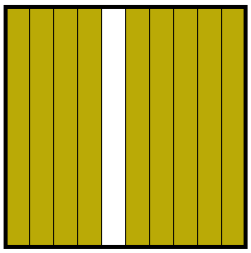

fraction $^{9}/_{10}$
décimal 0,9
pourcentage 90

1)

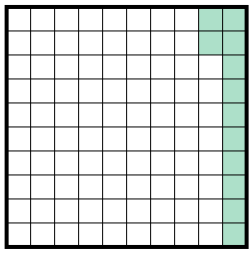

fraction $^{12}/_{100}$
décimal 0,12
pourcentage 12

2)

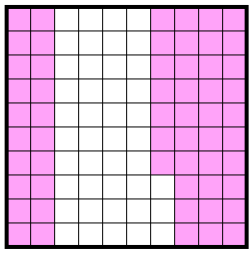

fraction $^{57}/_{100}$
décimal 0,57
pourcentage 57

3)

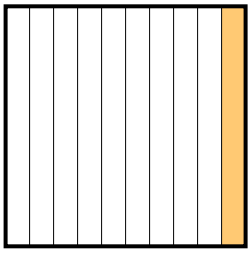

fraction $^{1}/_{10}$
décimal 0,1
pourcentage 10

4)

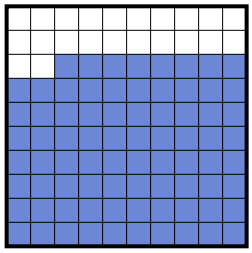

fraction $^{78}/_{100}$
décimal 0,78
pourcentage 78

5)

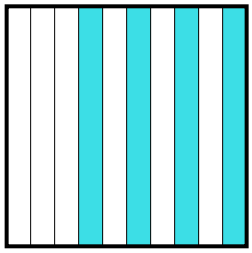

fraction $^{4}/_{10}$
décimal 0,4
pourcentage 40

6)

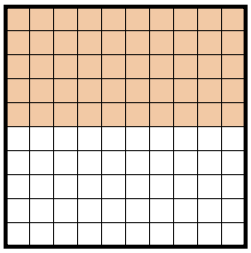

fraction $^{50}/_{100}$
décimal 0,50
pourcentage 50

7)

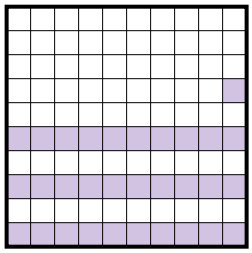

fraction $^{31}/_{100}$
décimal 0,31
pourcentage 31

8)

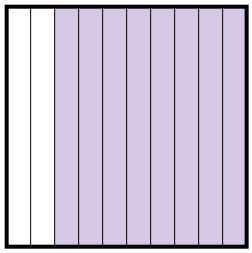

fraction $^{8}/_{10}$
décimal 0,8
pourcentage 80

9)

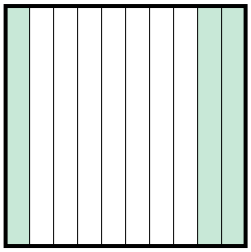

fraction $^{3}/_{10}$
décimal 0,3
pourcentage 30

10)

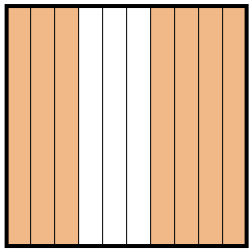

fraction $^{7}/_{10}$
décimal 0,7
pourcentage 70

11)

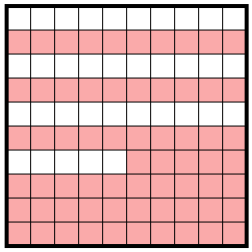

fraction $^{65}/_{100}$
décimal 0,65
pourcentage 65

Réponses

Ex.	$^{9}/_{10}$	0,9	90%
1.	$^{12}/_{100}$	0,12	12%
2.	$^{57}/_{100}$	0,57	57%
3.	$^{1}/_{10}$	0,1	10%
4.	$^{78}/_{100}$	0,78	78%
5.	$^{4}/_{10}$	0,4	40%
6.	$^{50}/_{100}$	0,50	50%
7.	$^{31}/_{100}$	0,31	31%
8.	$^{8}/_{10}$	0,8	80%
9.	$^{3}/_{10}$	0,3	30%
10.	$^{7}/_{10}$	0,7	70%
11.	$^{65}/_{100}$	0,65	65%

1-10	91	82	73	64	55	45	36	27	18	9
11	0									

Fraction, Décimal & Pourcentage (Visuel) Nom:

Exprimez la valeur en fraction , décimal & pourcentage.

Ex)

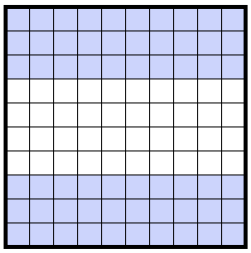

fraction $^{60}/_{100}$
décimal 0,60
pourcentage 60

1)

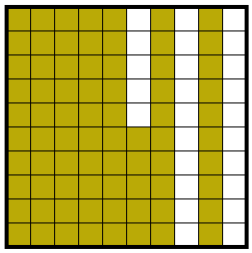

fraction _____
décimal _____
pourcentage _____

2)

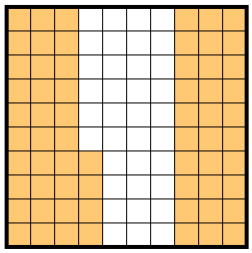

fraction _____
décimal _____
pourcentage _____

3)

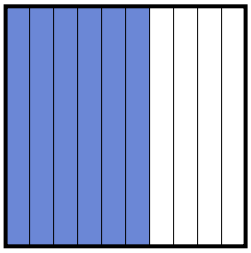

fraction _____
décimal _____
pourcentage _____

4)

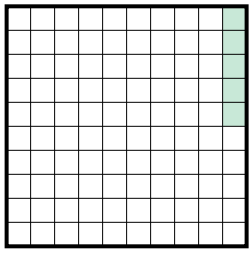

fraction _____
décimal _____
pourcentage _____

5)

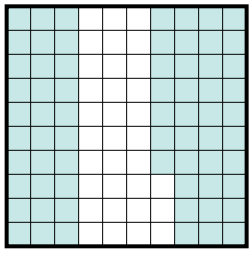

fraction _____
décimal _____
pourcentage _____

6)

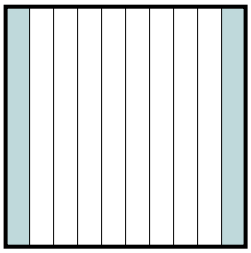

fraction _____
décimal _____
pourcentage _____

7)

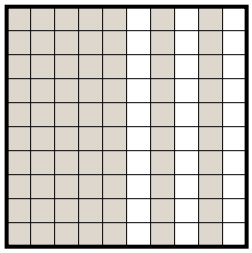

fraction _____
décimal _____
pourcentage _____

8)

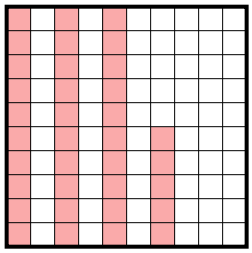

fraction _____
décimal _____
pourcentage _____

9)



fraction _____
décimal _____
pourcentage _____

10)



fraction _____
décimal _____
pourcentage _____

11)

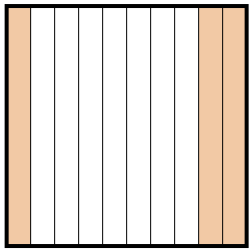

fraction _____
décimal _____
pourcentage _____

Réponses

Ex.	$^{60}/_{100}$	0,60	60%
1.			
2.			
3.			
4.			
5.			
6.			
7.			
8.			
9.			
10.			
11.			

1-10	91	82	73	64	55	45	36	27	18	9
11	0									

Fraction, Décimal & Pourcentage (Visuel) Nom: **Clé**

Exprimez la valeur en fraction , décimal & pourcentage.

Ex)

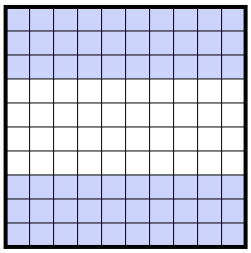

fraction $^{60}/_{100}$
décimal 0,60
pourcentage 60

1)

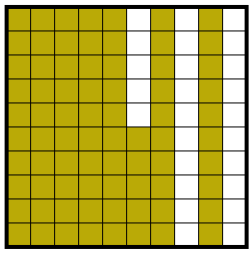

fraction $^{75}/_{100}$
décimal 0,75
pourcentage 75

2)

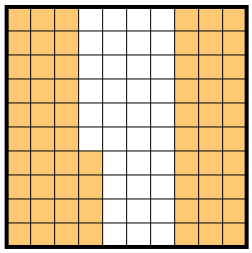

fraction $^{64}/_{100}$
décimal 0,64
pourcentage 64

3)

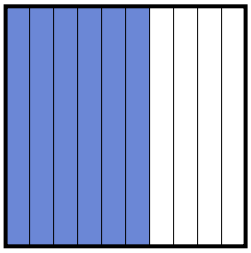

fraction $^{6}/_{10}$
décimal 0,6
pourcentage 60

4)

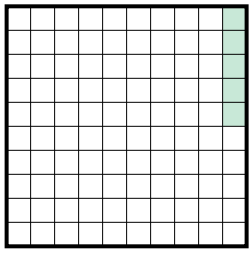

fraction $^{5}/_{100}$
décimal 0,05
pourcentage 5

5)

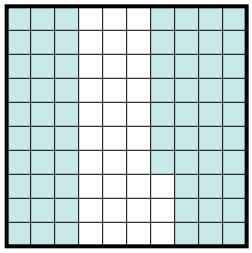

fraction $^{67}/_{100}$
décimal 0,67
pourcentage 67

6)

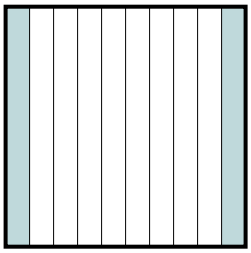

fraction $^{2}/_{10}$
décimal 0,2
pourcentage 20

7)

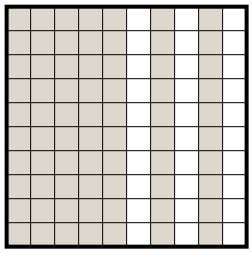

fraction $^{70}/_{100}$
décimal 0,70
pourcentage 70

8)

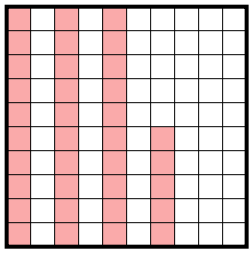

fraction $^{35}/_{100}$
décimal 0,35
pourcentage 35

9)



fraction $^{9}/_{10}$
décimal 0,9
pourcentage 90

10)



fraction $^{8}/_{10}$
décimal 0,8
pourcentage 80

11)

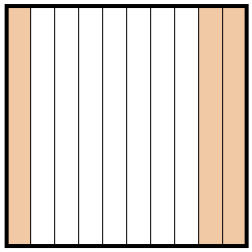

fraction $^{3}/_{10}$
décimal 0,3
pourcentage 30

Réponses

Ex.	$^{60}/_{100}$	0,60	60%
1.	$^{75}/_{100}$	0,75	75%
2.	$^{64}/_{100}$	0,64	64%
3.	$^{6}/_{10}$	0,6	60%
4.	$^{5}/_{100}$	0,05	5%
5.	$^{67}/_{100}$	0,67	67%
6.	$^{2}/_{10}$	0,2	20%
7.	$^{70}/_{100}$	0,70	70%
8.	$^{35}/_{100}$	0,35	35%
9.	$^{9}/_{10}$	0,9	90%
10.	$^{8}/_{10}$	0,8	80%
11.	$^{3}/_{10}$	0,3	30%

1-10	91	82	73	64	55	45	36	27	18	9
11	0									